Determining Value with Blocks

Name:

Find the value each set of blocks represents.

1) 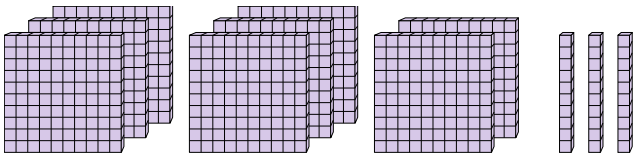

2) 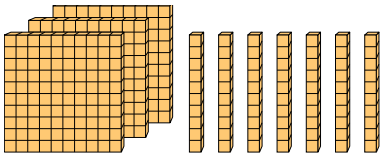

3) 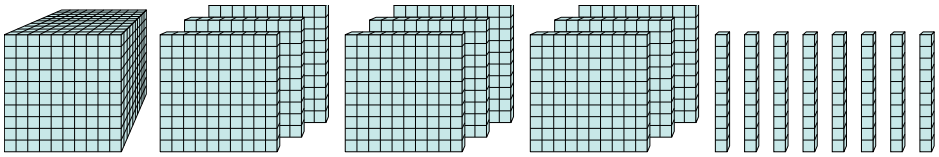

4) 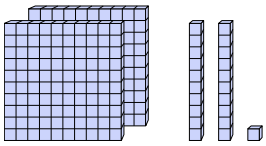

5) 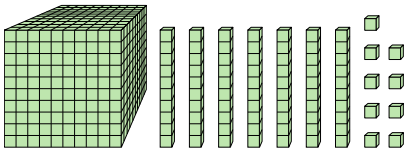

6) 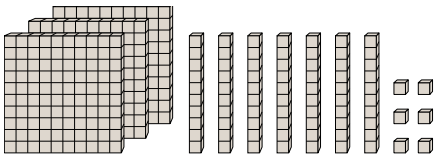

7) 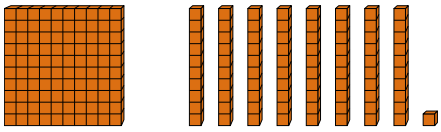

8) 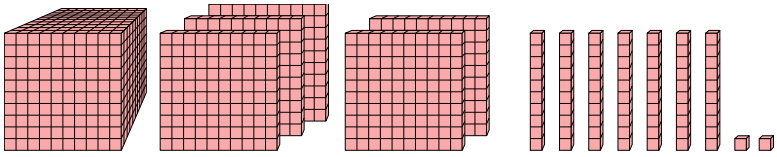

9) 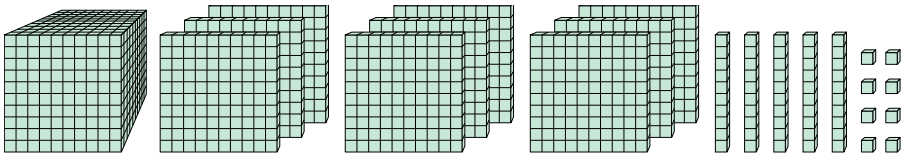

10) 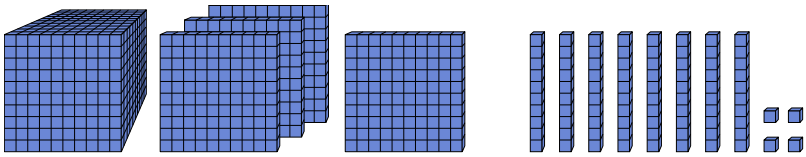

Answers

1. _____
2. _____
3. _____
4. _____
5. _____
6. _____
7. _____
8. _____
9. _____
10. _____

1-10	90	80	70	60	50	40	30	20	10	0

Determining Value with Blocks

Name: **Answer Key**

Find the value each set of blocks represents.

1) 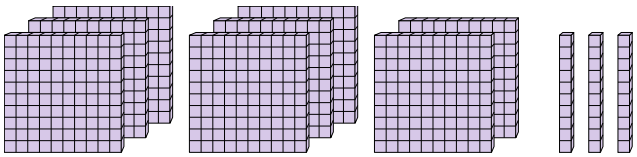

2) 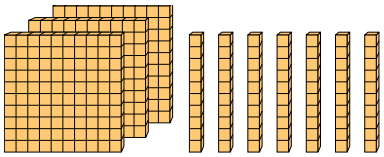

3) 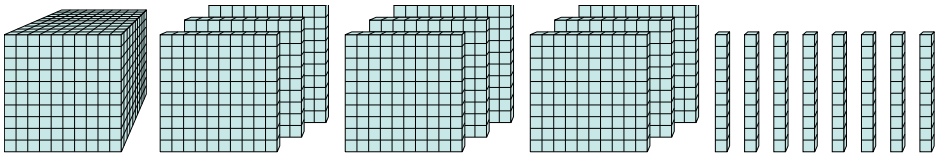

4) 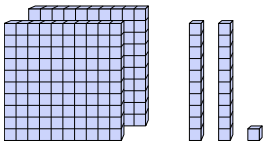

5) 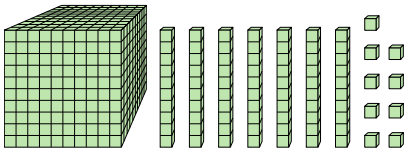

6) 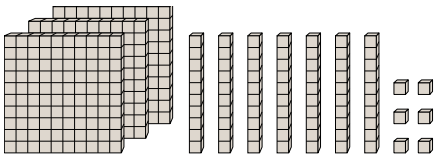

7) 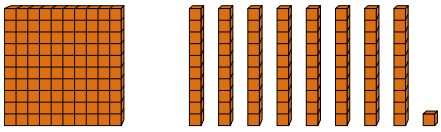

8) 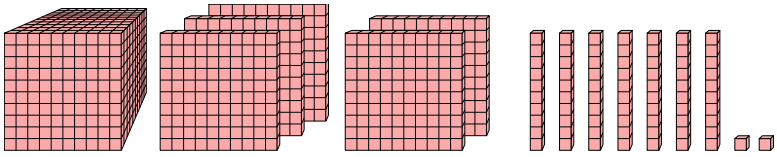

9) 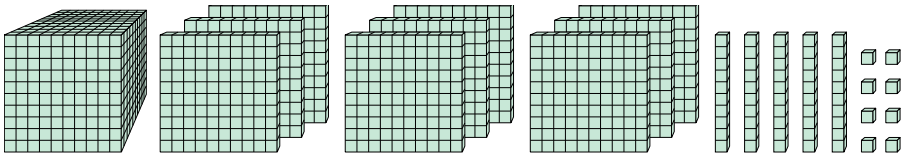

10) 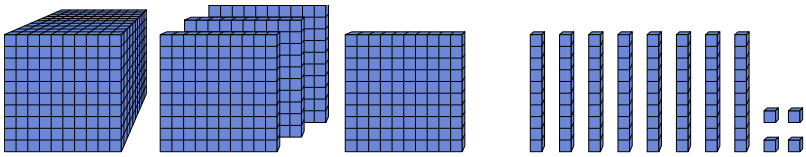

Answers

1. **830**
2. **370**
3. **1,980**
4. **221**
5. **1,079**
6. **376**
7. **181**
8. **1,572**
9. **1,958**
10. **1,484**

1-10	90	80	70	60	50	40	30	20	10	0