Determining Value with Blocks Name:

Find the value each set of blocks represents.

1) 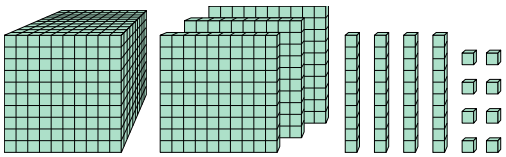

2) 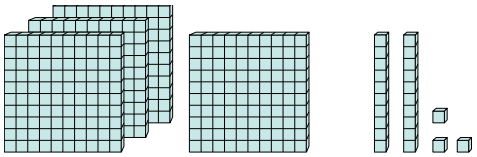

3) 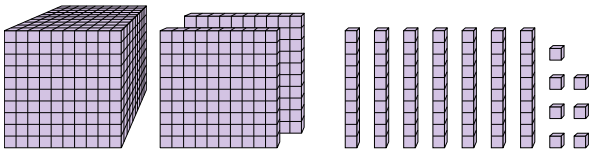

4) 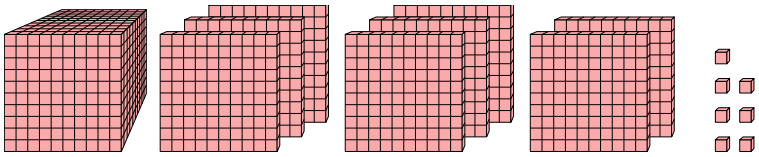

5) 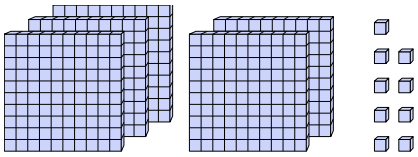

6) 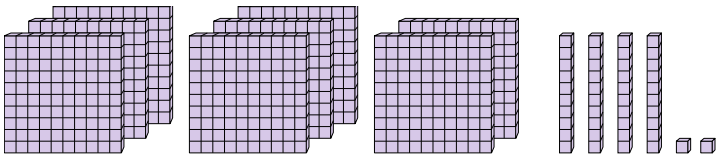

7) 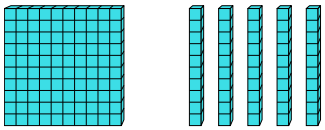

8) 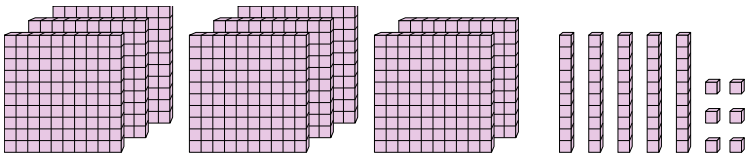

9) 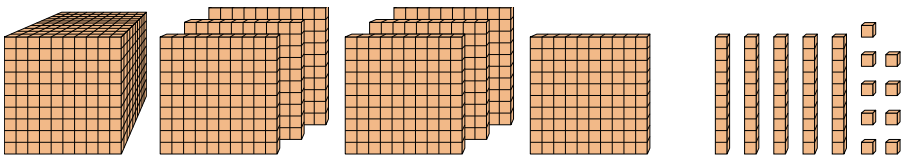

10) 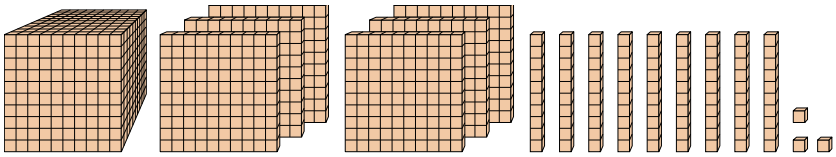

Answers

1. _____
2. _____
3. _____
4. _____
5. _____
6. _____
7. _____
8. _____
9. _____
10. _____

1-10	90	80	70	60	50	40	30	20	10	0

Determining Value with Blocks

Name: **Answer Key**

Find the value each set of blocks represents.

1) 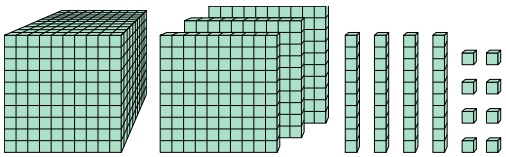

2) 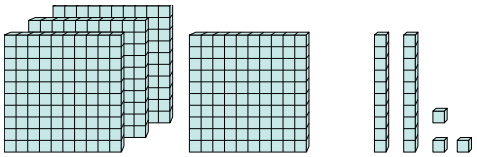

3) 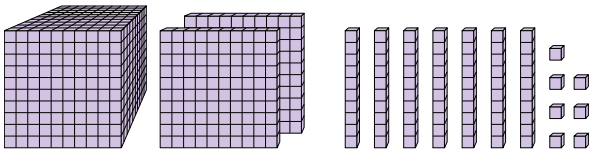

4) 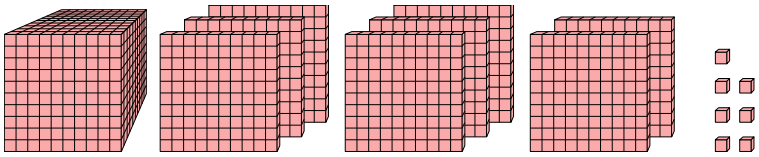

5) 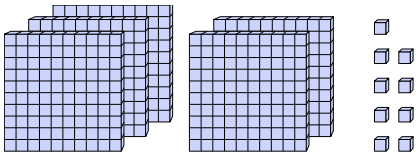

6) 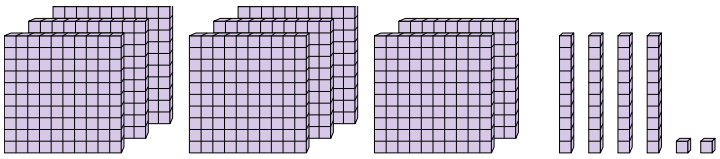

7) 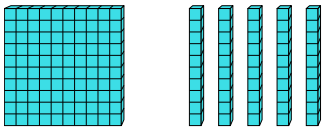

8) 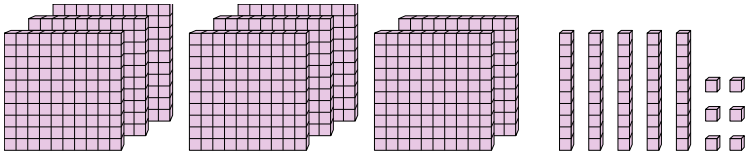

9) 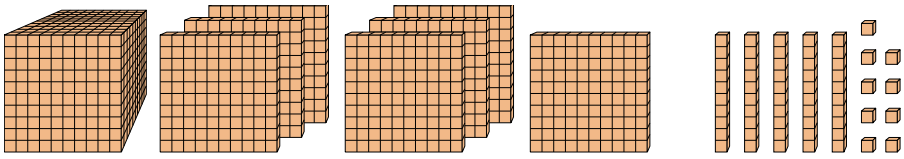

10) 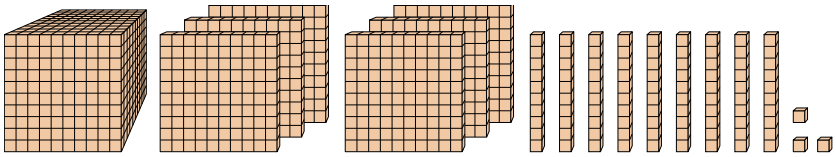

Answers

1. **1,348**
2. **423**
3. **1,277**
4. **1,807**
5. **509**
6. **842**
7. **150**
8. **856**
9. **1,759**
10. **1,693**

1-10	90	80	70	60	50	40	30	20	10	0