Determining Place Value with Blocks

Name:

Solve each problem.

1)

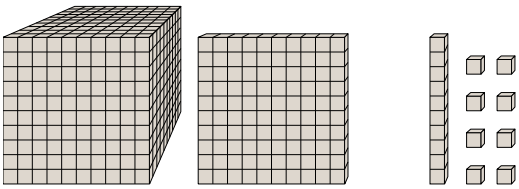

What digit is in the thousands place in the number above?

2)

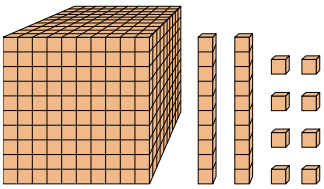

What digit is in the hundreds place in the number above?

3)

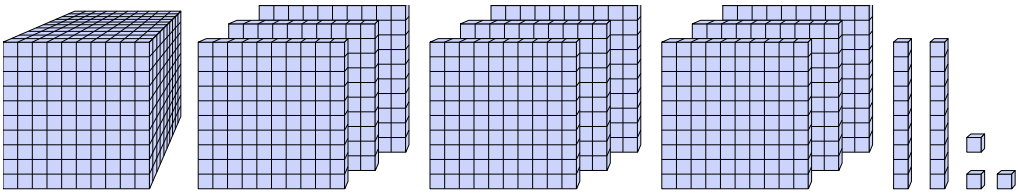

What digit is in the tens place in the number above?

4)

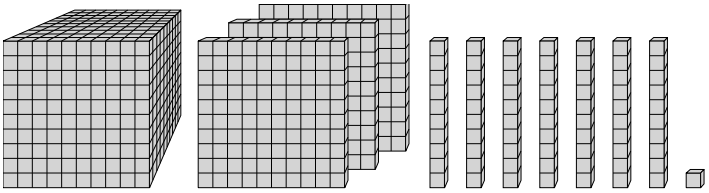

What digit is in the ones place in the number above?

5)

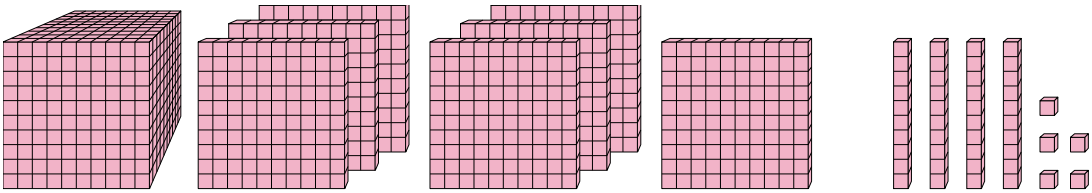

What digit is in the thousands place in the number above?

6)

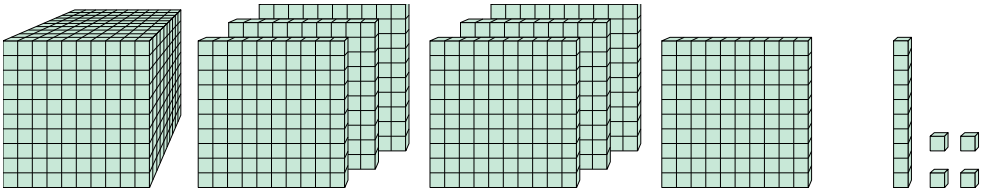

What digit is in the hundreds place in the number above?

Answers

1. _____
2. _____
3. _____
4. _____
5. _____
6. _____

1-6	83	67	50	33	17	0

Determining Place Value with Blocks

Name: **Answer Key**

Solve each problem.

1)

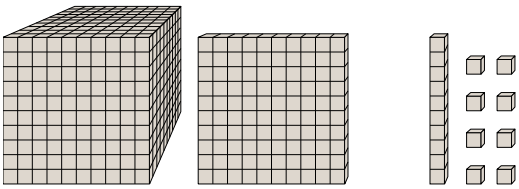

What digit is in the thousands place in the number above?

2)

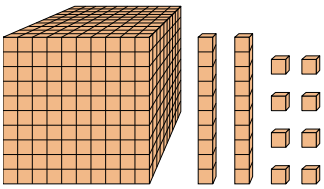

What digit is in the hundreds place in the number above?

3)

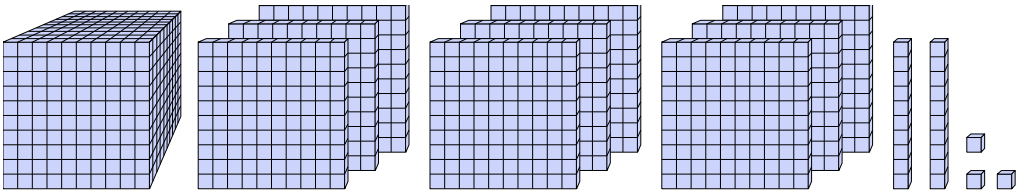

What digit is in the tens place in the number above?

4)

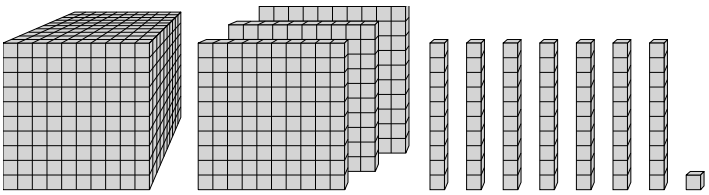

What digit is in the ones place in the number above?

5)

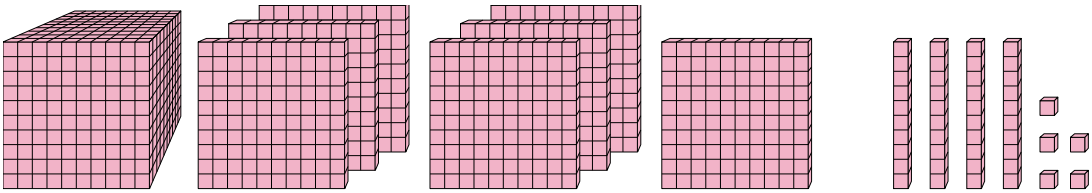

What digit is in the thousands place in the number above?

6)

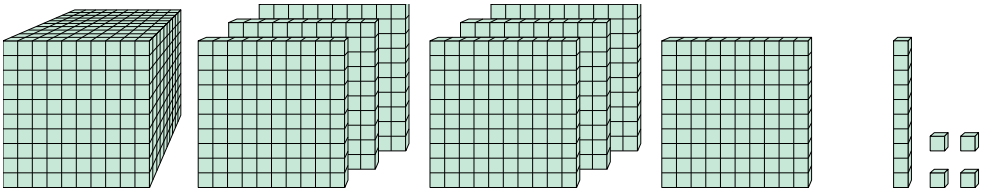

What digit is in the hundreds place in the number above?

Answers

1. **1**
2. **0**
3. **2**
4. **1**
5. **1**
6. **7**

1-6	83	67	50	33	17	0