Counting Figures Name:

Count the number of shapes in each box.

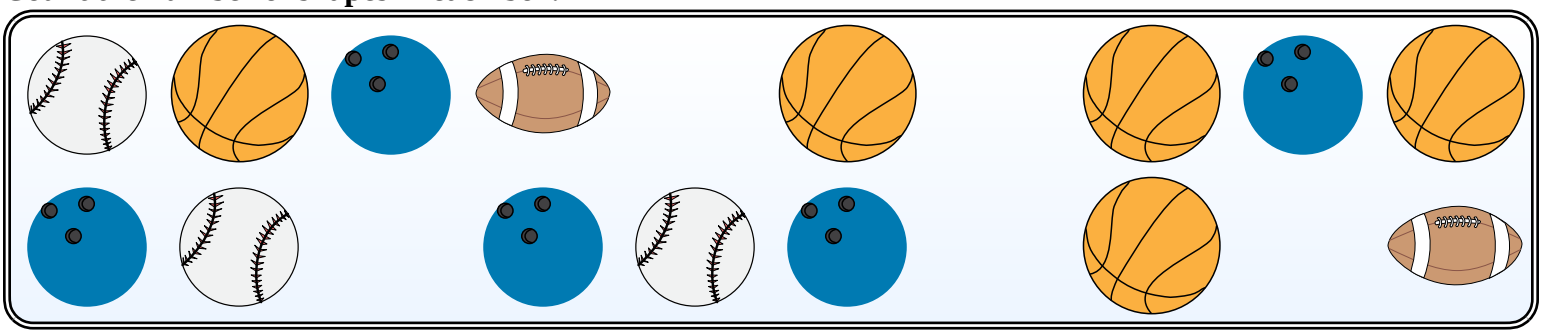

Ex) = 3

1) = _____

2) = _____

3) = _____



4) = _____

5) = _____

6) = _____

7) = _____



8) = _____

9) = _____

10) = _____

11) = _____

1-10	91	82	73	64	55	45	36	27	18	9
11	0									

Counting Figures

Name: **Answer Key**

Count the number of shapes in each box.

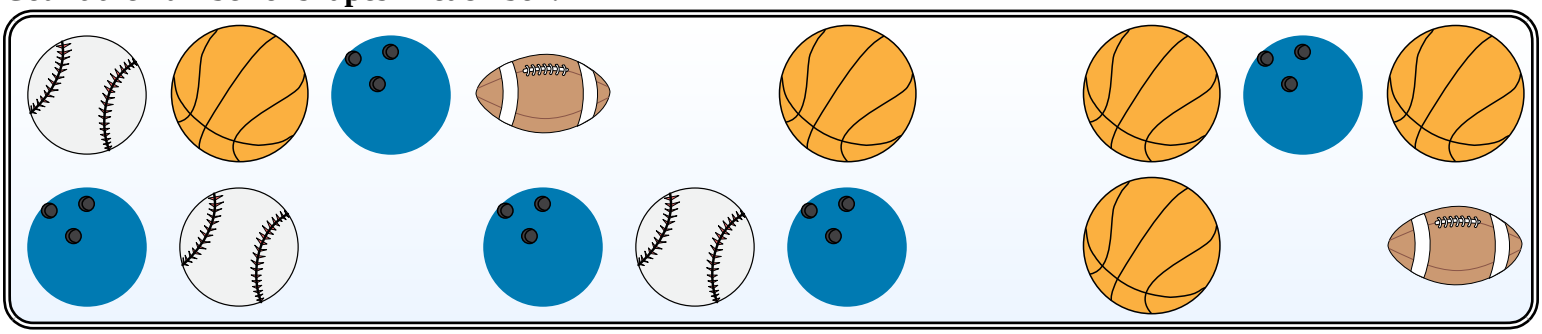

Ex) = 3

1) = 5

2) = 5

3) = 2



4) = 4

5) = 2

6) = 6

7) = 2



8) = 3

9) = 4

10) = 4

11) = 3

1-10	91	82	73	64	55	45	36	27	18	9
11	0									

Counting Figures Name:

Count the number of shapes in each box.

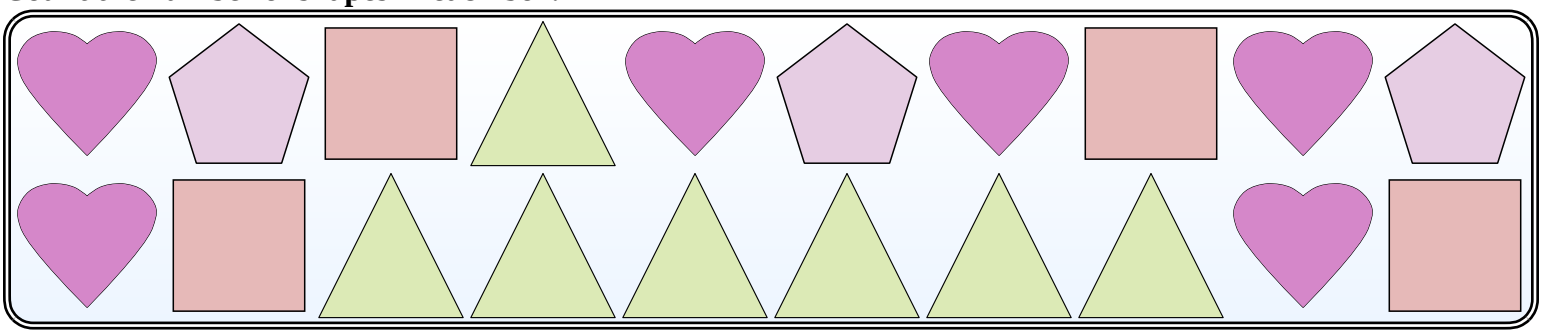

Ex) = 6

1) 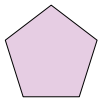 = _____

2) = _____

3) 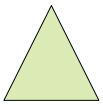 = _____

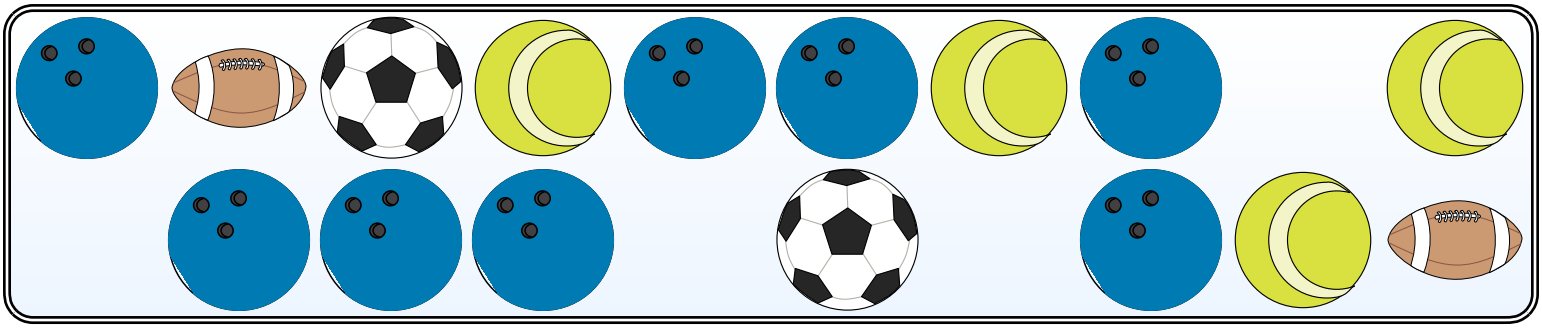

4) = _____

5) = _____

6) = _____

7) = _____



8) = _____

9) = _____

10) = _____

11) = _____

1-10	91	82	73	64	55	45	36	27	18	9
11	0									

Counting Figures

Name: **Answer Key**

Count the number of shapes in each box.

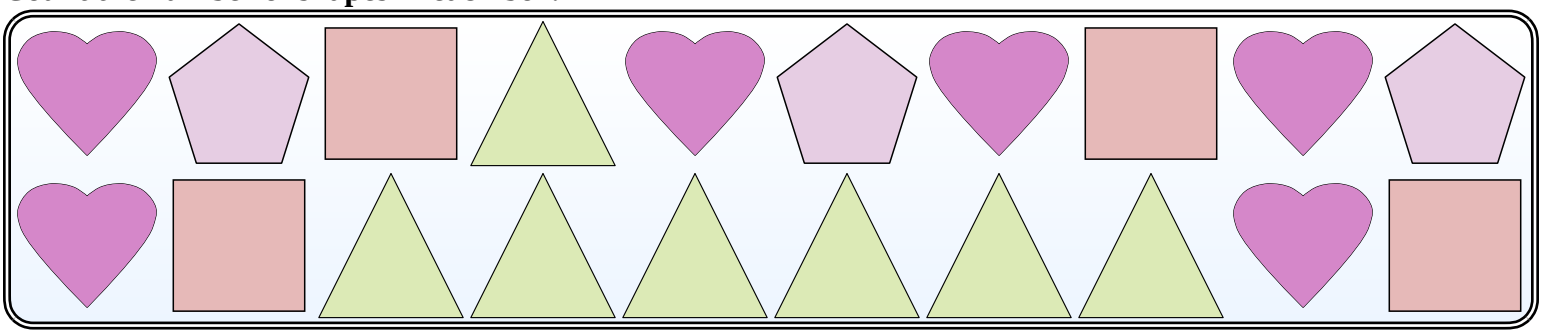

Ex) = 6

1) 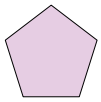 = 3

2) = 4

3) 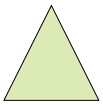 = 7

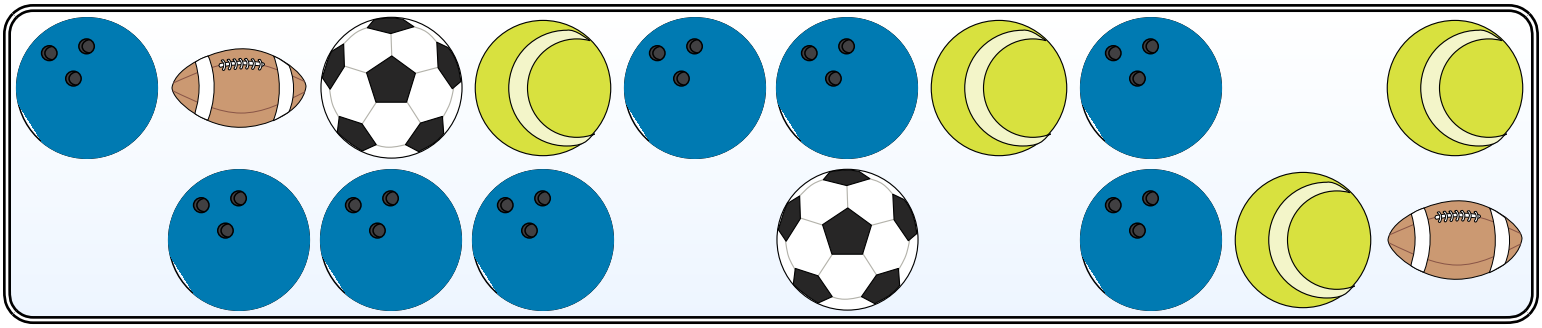

4) = 8

5) = 2

6) = 2

7) = 4



8) = 5

9) = 4

10) = 8

11) = 1

1-10	91	82	73	64	55	45	36	27	18	9
11	0									

Counting Figures Name:

Count the number of shapes in each box.

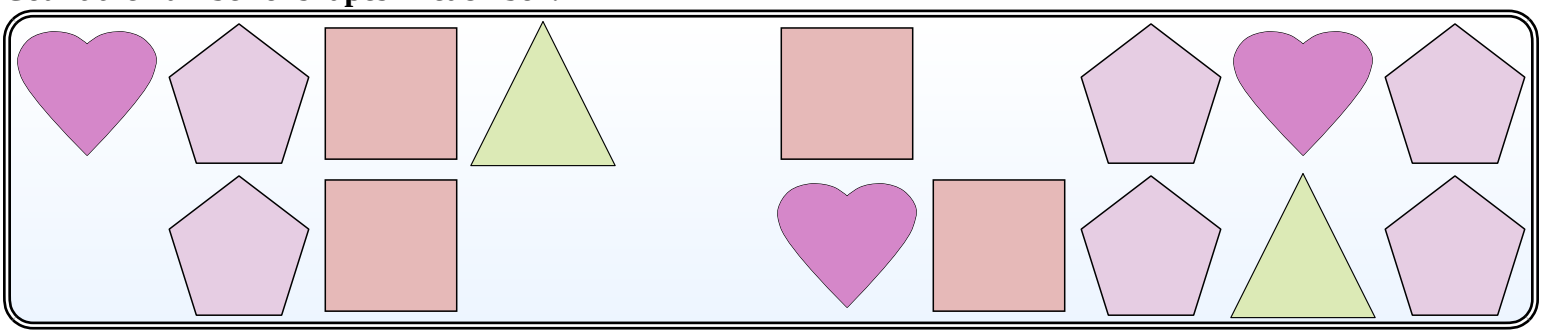

Ex) = 3

1) 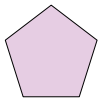 = _____

2) = _____

3) 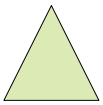 = _____

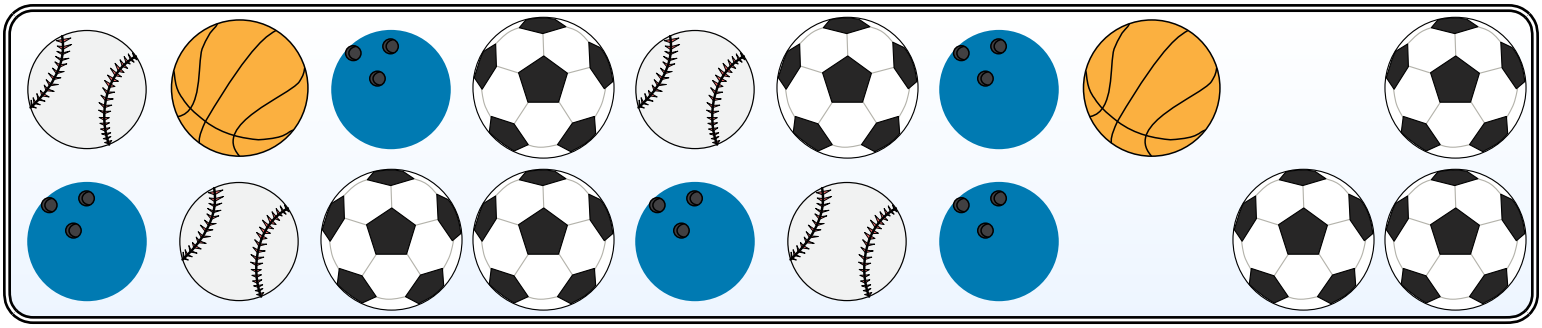

4) = _____

5) = _____

6) = _____

7) = _____



8) = _____

9) = _____

10) = _____

11) = _____

1-10	91	82	73	64	55	45	36	27	18	9
11	0									

Counting Figures

Name: **Answer Key**

Count the number of shapes in each box.

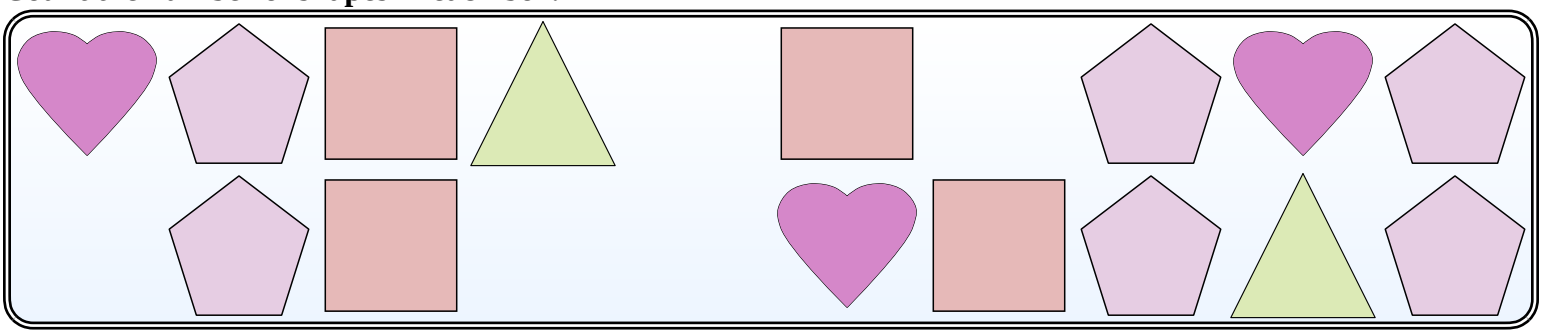

Ex) = 3

1) 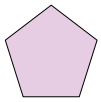 = 6

2) = 4

3) 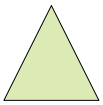 = 2

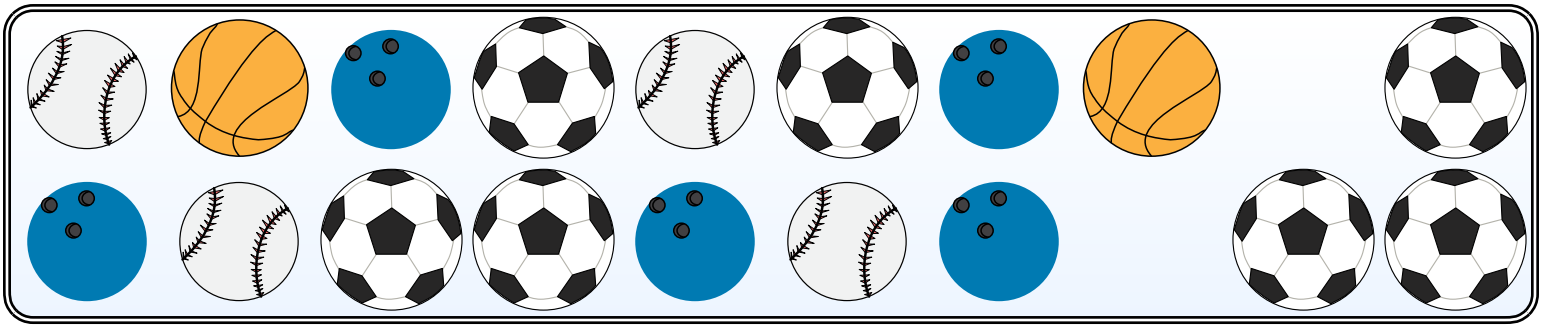

4) = 4

5) = 2

6) = 5

7) = 7



8) = 6

9) = 4

10) = 3

11) = 6

1-10	91	82	73	64	55	45	36	27	18	9
11	0									

Counting Figures Name:

Count the number of shapes in each box.



Ex) = 3

1) = _____

2) = _____

3) 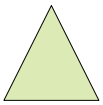 = _____

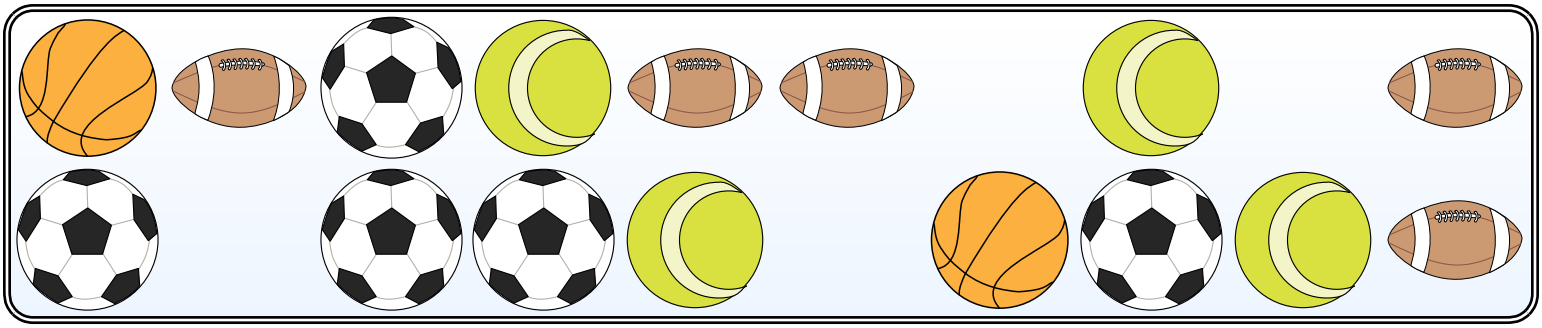

4) = _____

5) = _____

6) = _____

7) = _____



8) = _____

9) = _____

10) = _____

11) = _____

1-10	91	82	73	64	55	45	36	27	18	9
11	0									

Counting Figures

Name: **Answer Key**

Count the number of shapes in each box.



Ex) = 3

1) = 1

2) = 7

3) 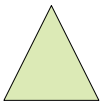 = 5

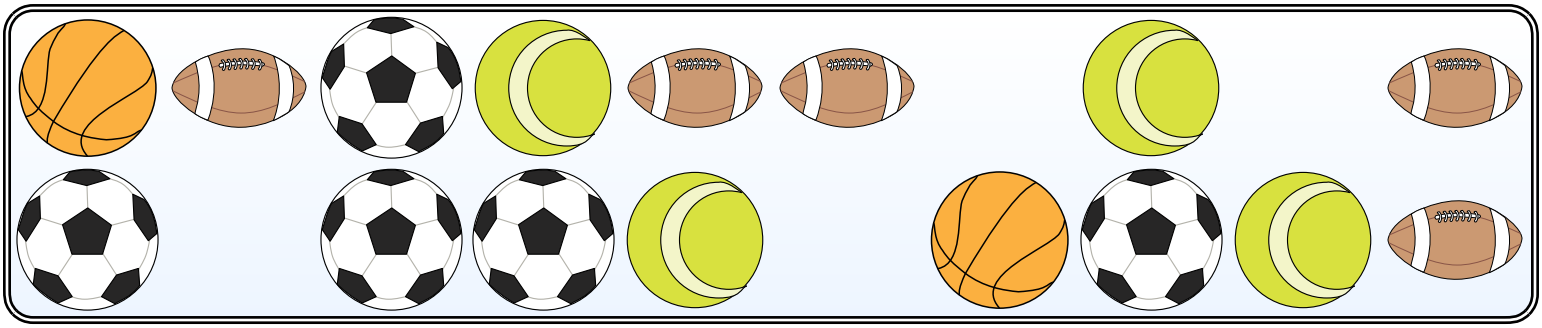

4) = 2

5) = 5

6) = 5

7) = 4



8) = 4

9) = 6

10) = 5

11) = 4

1-10	91	82	73	64	55	45	36	27	18	9
11	0									

Counting Figures Name:

Count the number of shapes in each box.

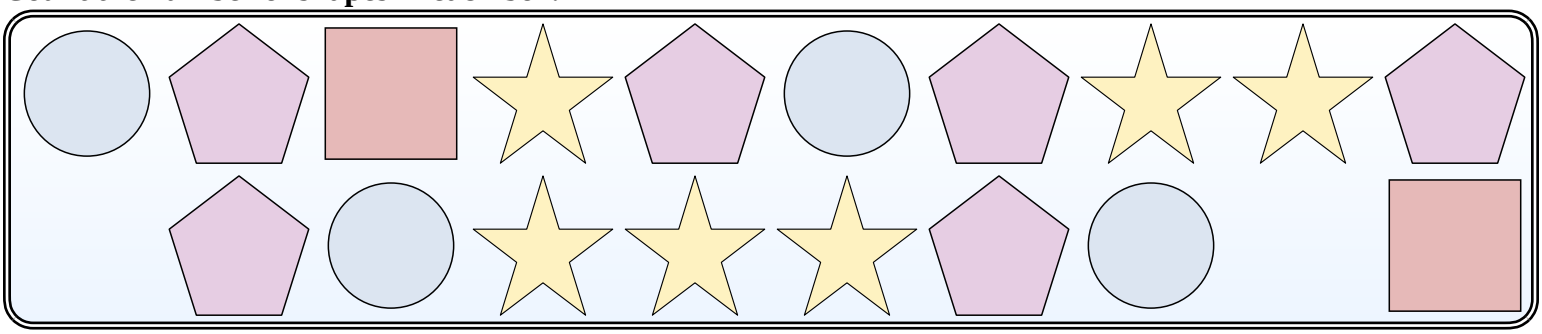

Ex) = 4

1) 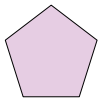 = _____

2) = _____

3) = _____



4) = _____

5) = _____

6) = _____

7) = _____



8) = _____

9) = _____

10) = _____

11) = _____

1-10	91	82	73	64	55	45	36	27	18	9
11	0									

Counting Figures

Name: **Answer Key**

Count the number of shapes in each box.

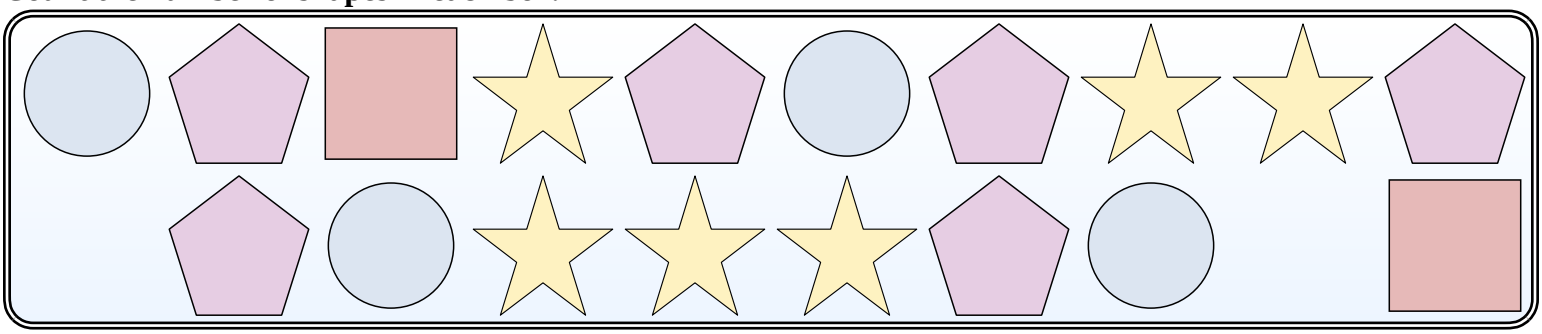

Ex) = 4

1) 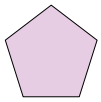 = 6

2) = 2

3) = 6



4) = 4

5) = 5

6) = 3

7) = 5



8) = 6

9) = 3

10) = 7

11) = 3

1-10	91	82	73	64	55	45	36	27	18	9
11	0									

Counting Figures Name:

Count the number of shapes in each box.

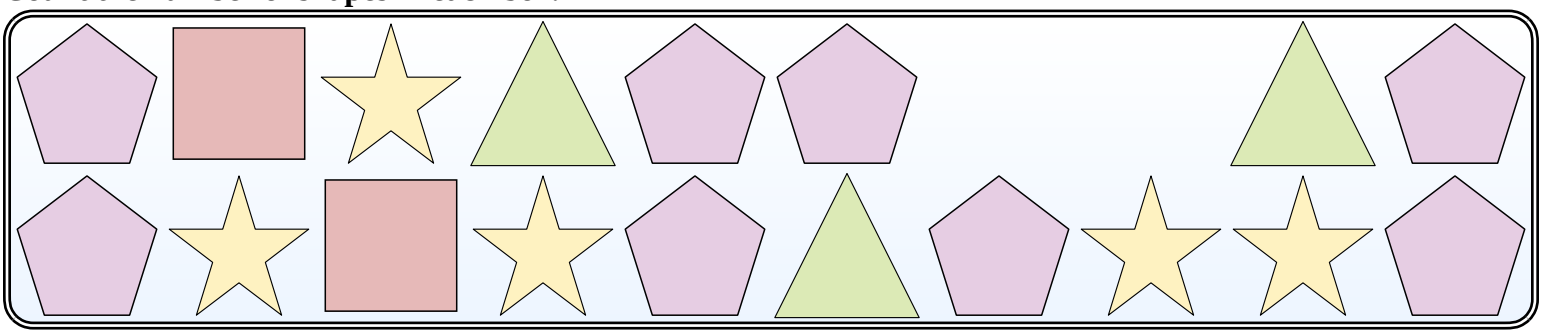

Ex) 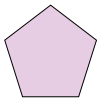 = 8

1) = _____

2) = _____

3) = _____



4) = _____

5) = _____

6) = _____

7) = _____

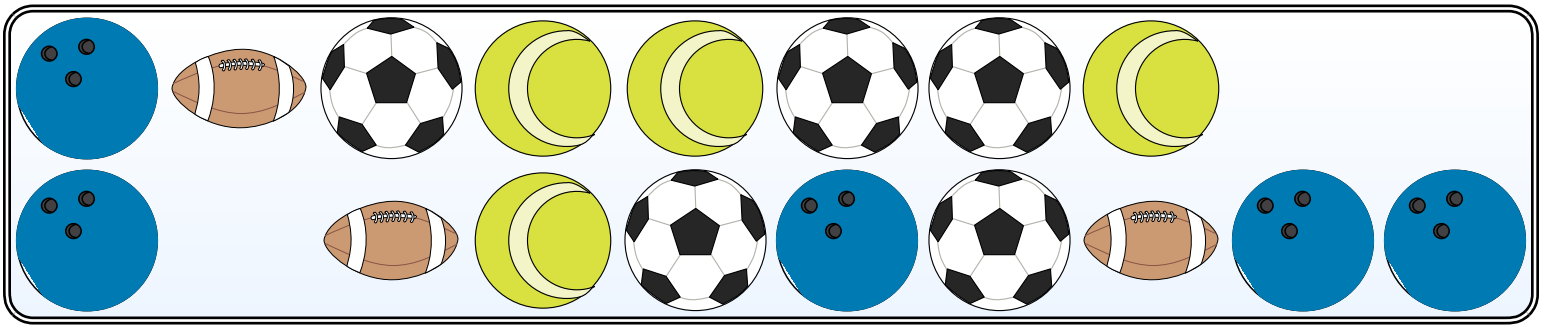

8)  = _____

9) = _____

10) = _____

11) = _____

1-10	91	82	73	64	55	45	36	27	18	9
11	0									

Counting Figures

Name: **Answer Key**

Count the number of shapes in each box.

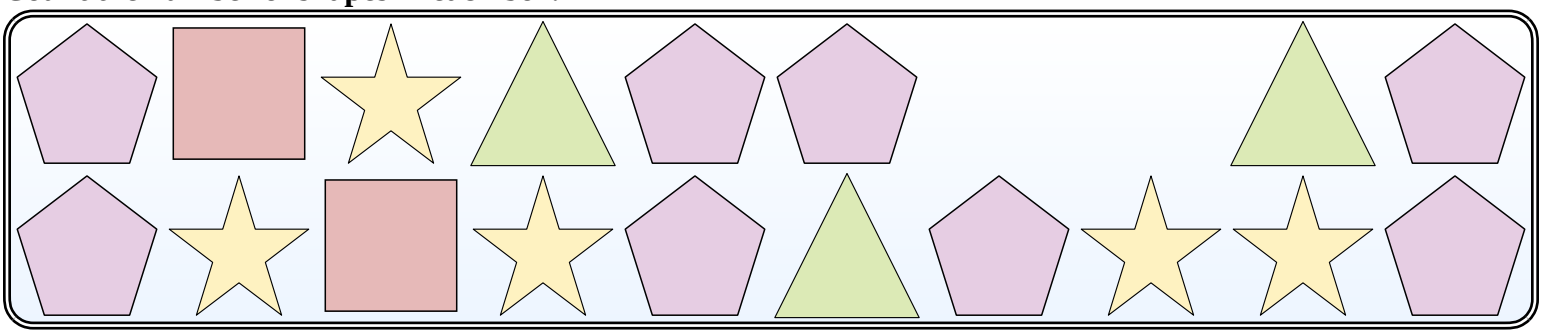

Ex) 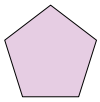 = 8

1) = 2

2) = 5

3) = 3



4) = 5

5) = 3

6) = 4

7) = 7

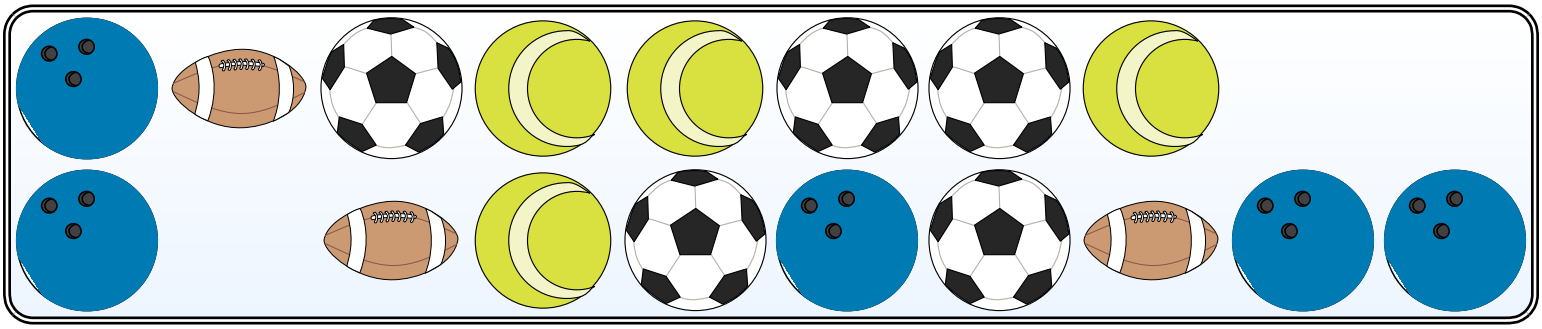

8)  = 5

9) = 3

10) = 5

11) = 4

1-10	91	82	73	64	55	45	36	27	18	9
11	0									

Counting Figures Name:

Count the number of shapes in each box.

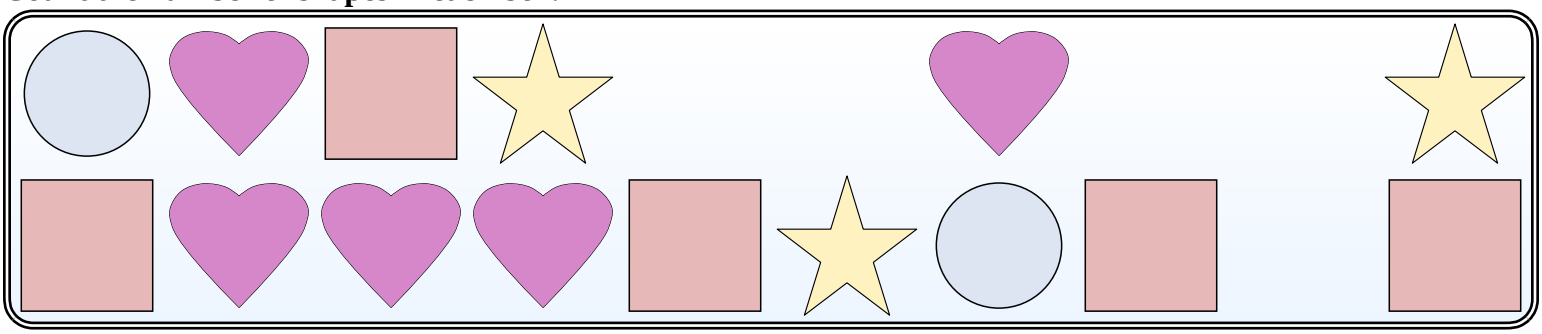

Ex) = 2

1) = _____

2) = _____

3) = _____

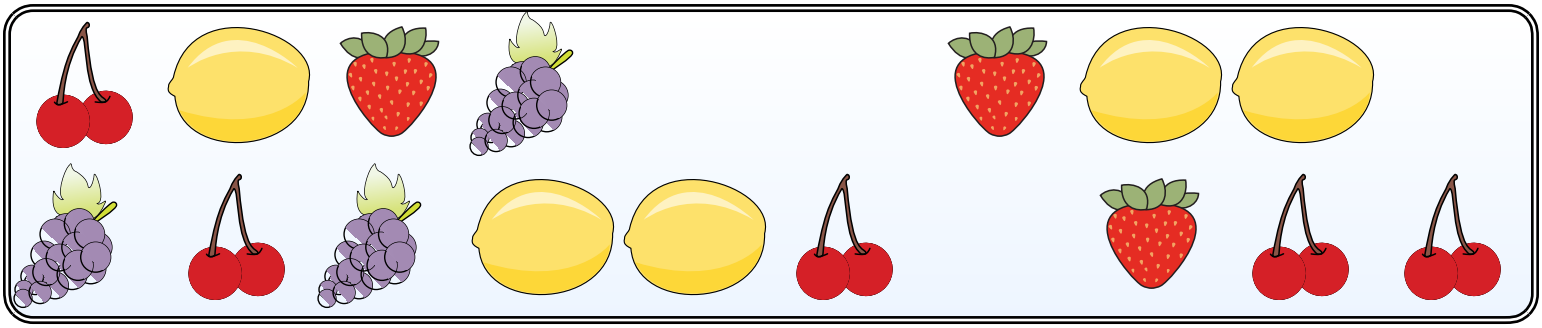

4) = _____

5) = _____

6) = _____

7) = _____



8) = _____

9) = _____

10) = _____

11) = _____

1-10	91	82	73	64	55	45	36	27	18	9
11	0									

Counting Figures

Name: **Answer Key**

Count the number of shapes in each box.

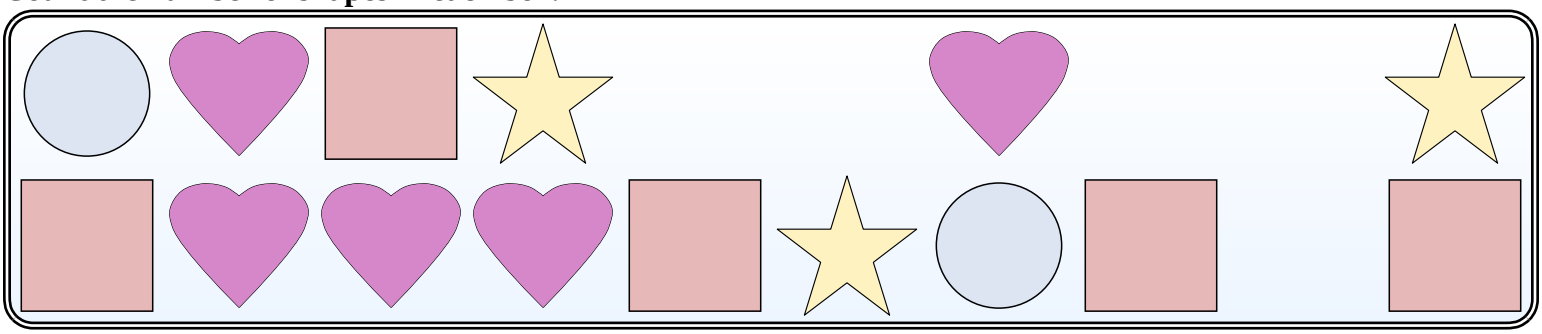

Ex) = 2

1) = 5

2) = 5

3) = 3

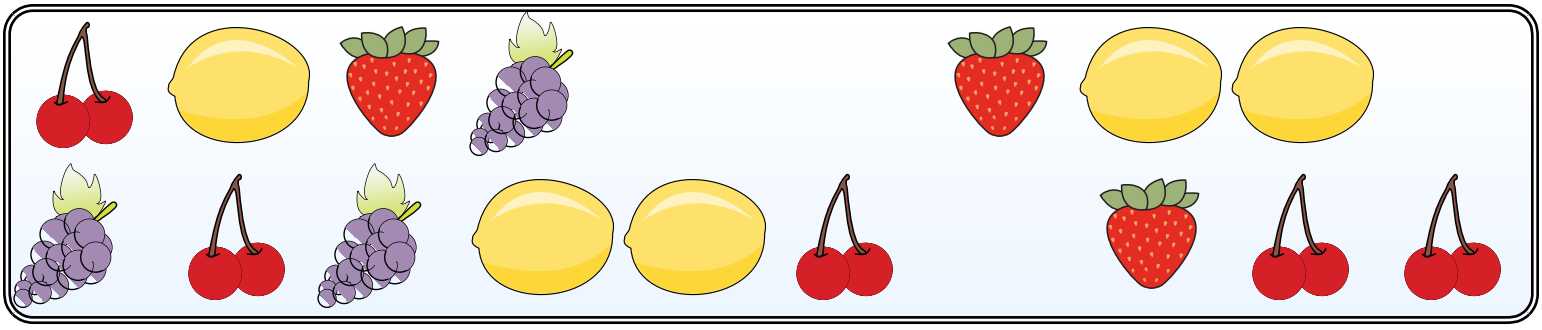

4) = 5

5) = 5

6) = 3

7) = 3



8) = 6

9) = 3

10) = 4

11) = 5

1-10	91	82	73	64	55	45	36	27	18	9
11	0									

Counting Figures Name:

Count the number of shapes in each box.

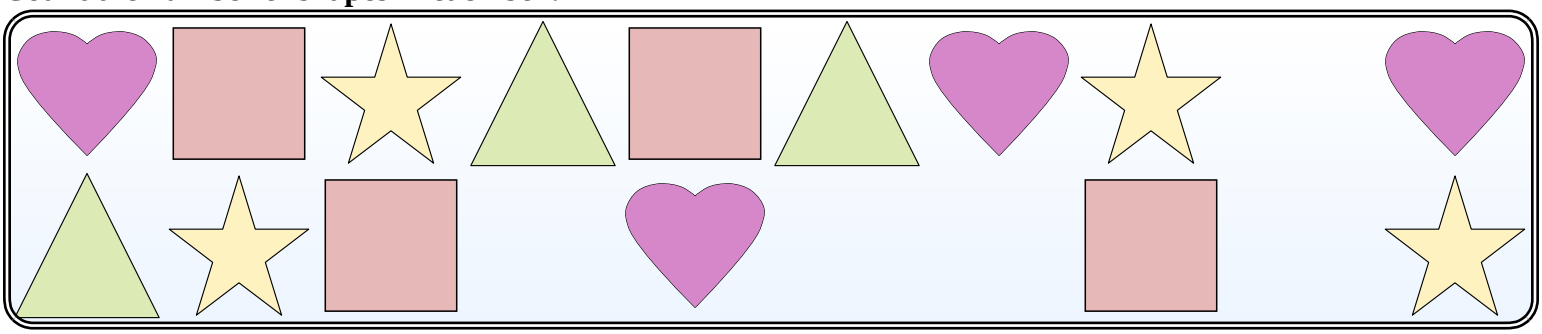

Ex) = 4

1) = _____

2) = _____

3) = _____



4) = _____

5) = _____

6) = _____

7) = _____

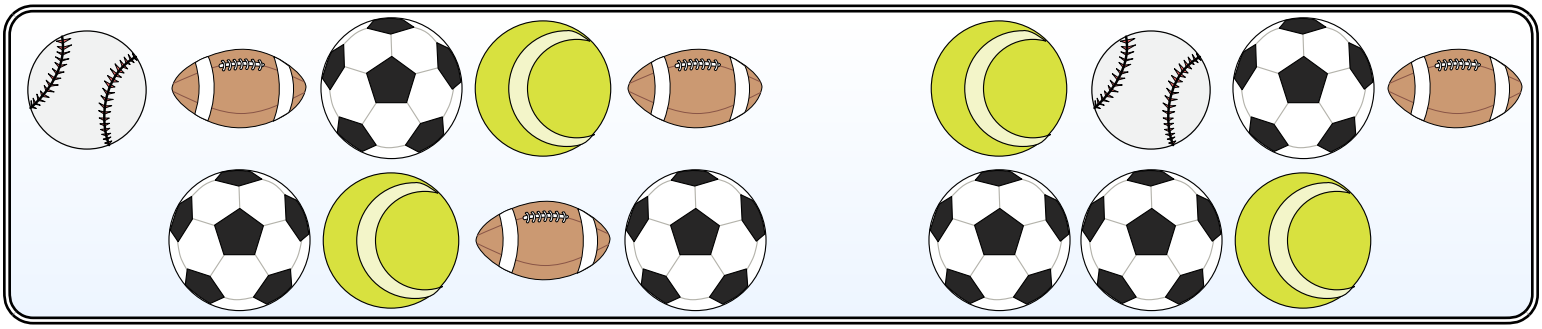

8) = _____

9) = _____

10) = _____

11) = _____

1-10	91	82	73	64	55	45	36	27	18	9
11	0									

Counting Figures

Name: **Answer Key**

Count the number of shapes in each box.

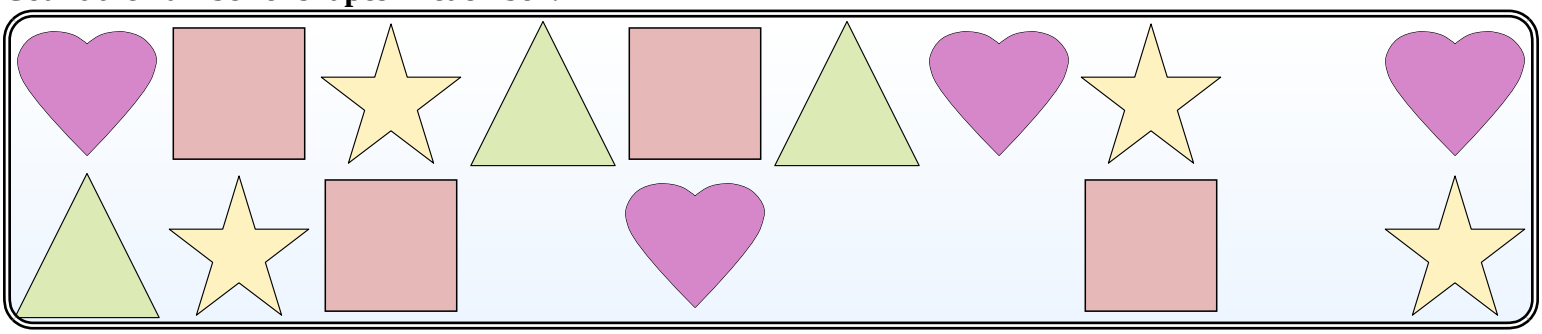

Ex) = 4

1) = 4

2) = 4

3) = 3



4) = 6

5) = 2

6) = 5

7) = 6

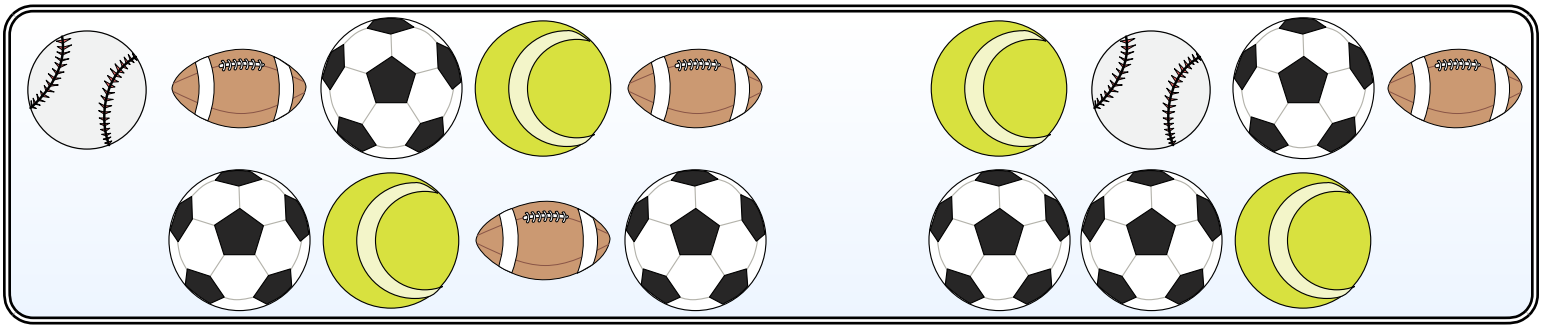

8) = 2

9) = 4

10) = 6

11) = 4

1-10	91	82	73	64	55	45	36	27	18	9
11	0									

Counting Figures Name:

Count the number of shapes in each box.

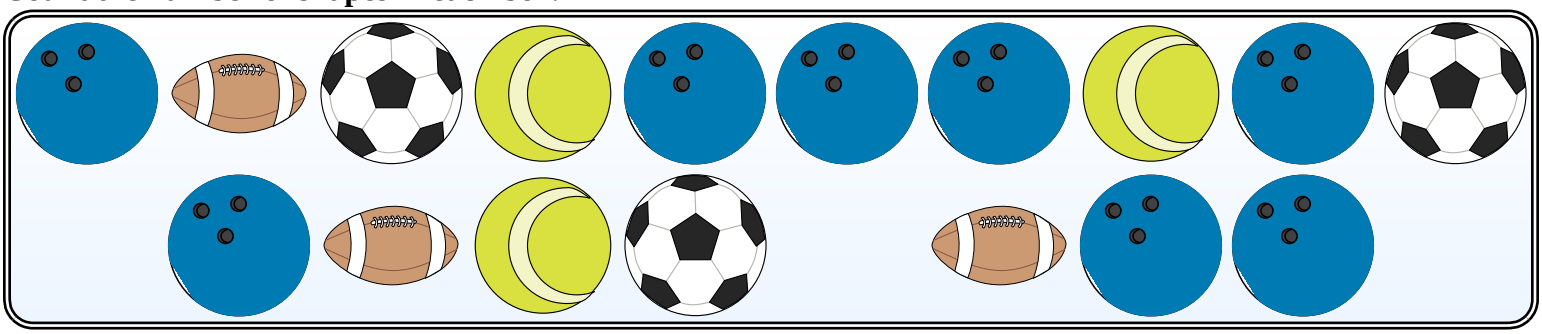

Ex) = 8

1) = _____

2) = _____

3) = _____



4) = _____

5) = _____

6) = _____

7) = _____

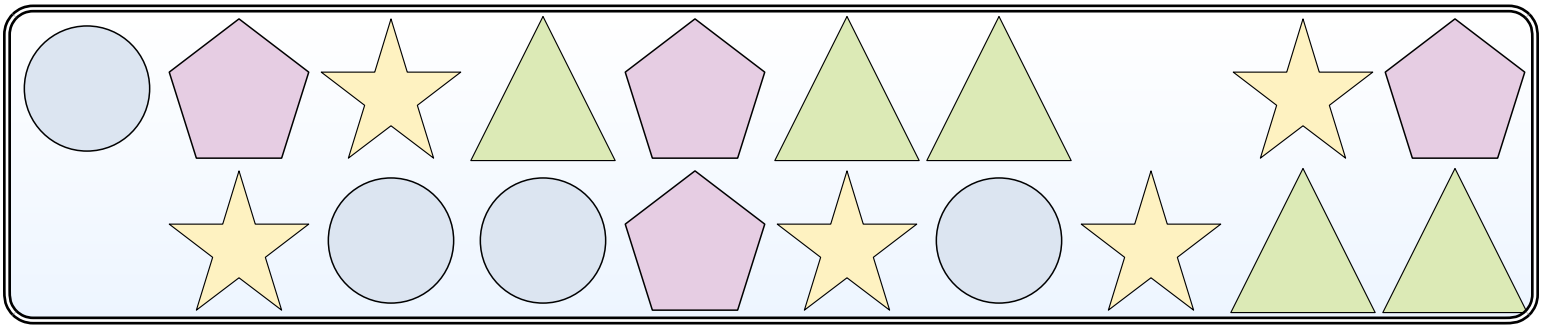

8) = _____

9) 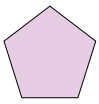 = _____

10) = _____

11) = _____

1-10	91	82	73	64	55	45	36	27	18	9
11	0									

Counting Figures

Name: **Answer Key**

Count the number of shapes in each box.

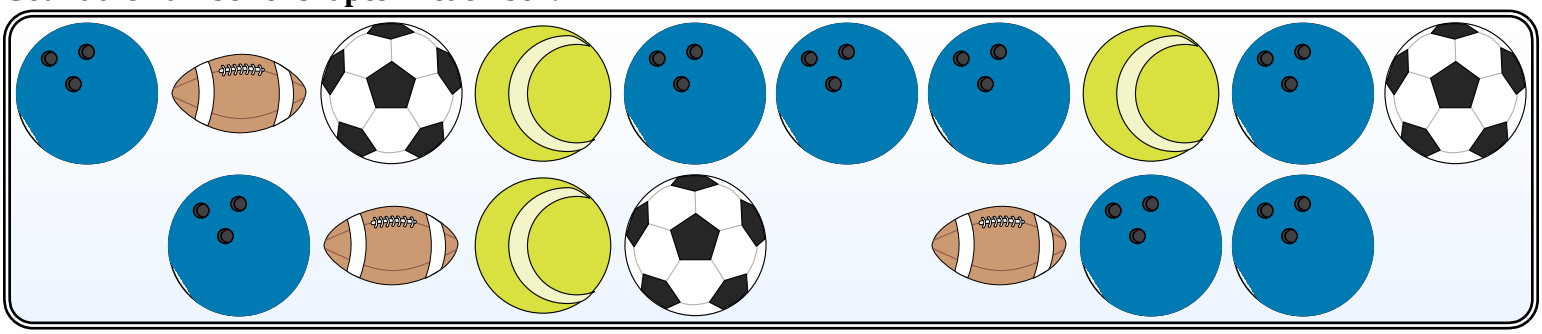

Ex) = 8

1) = 3

2) = 3

3) = 3



4) = 6

5) = 5

6) = 4

7) = 3

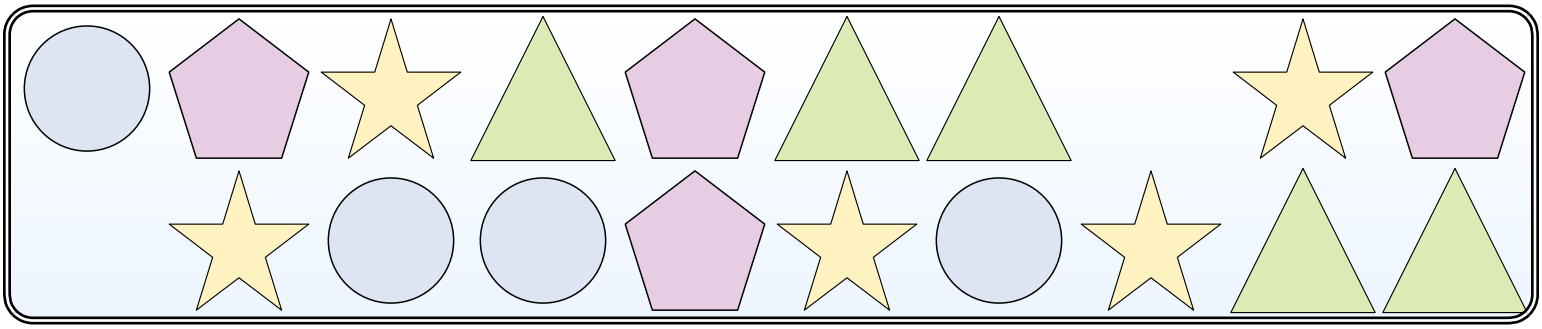

8) = 4

9) 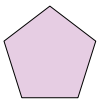 = 4

10) = 5

11) = 5

1-10	91	82	73	64	55	45	36	27	18	9
11	0									

Counting Figures Name:

Count the number of shapes in each box.



Ex) = 4

1) = _____

2) = _____

3) = _____



4) = _____

5) = _____

6) = _____

7) = _____

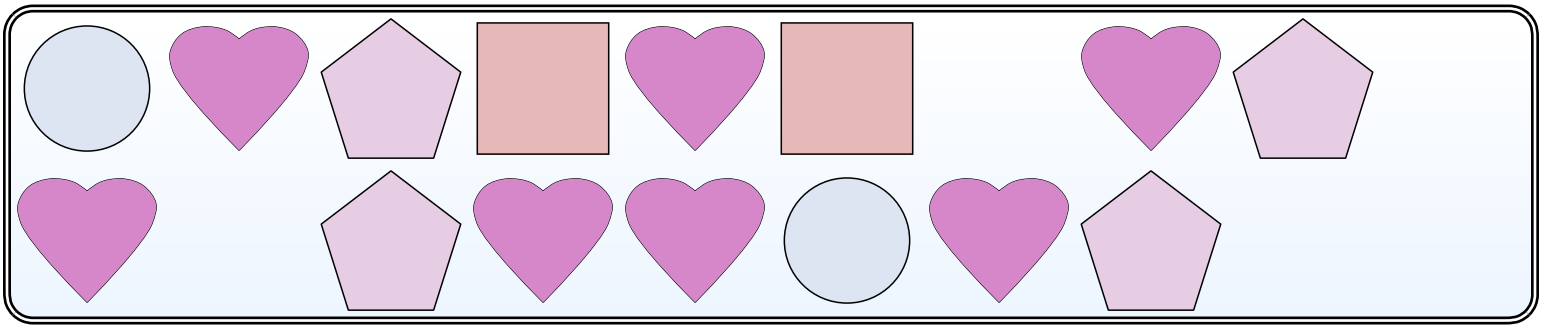

8) = _____

9) = _____

10) 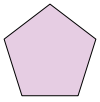 = _____

11) = _____

1-10	91	82	73	64	55	45	36	27	18	9
11	0									

Counting Figures

Name: **Answer Key**

Count the number of shapes in each box.



Ex) = 4

1) = 6

2) = 3

3) = 4



4) = 5

5) = 3

6) = 4

7) = 2

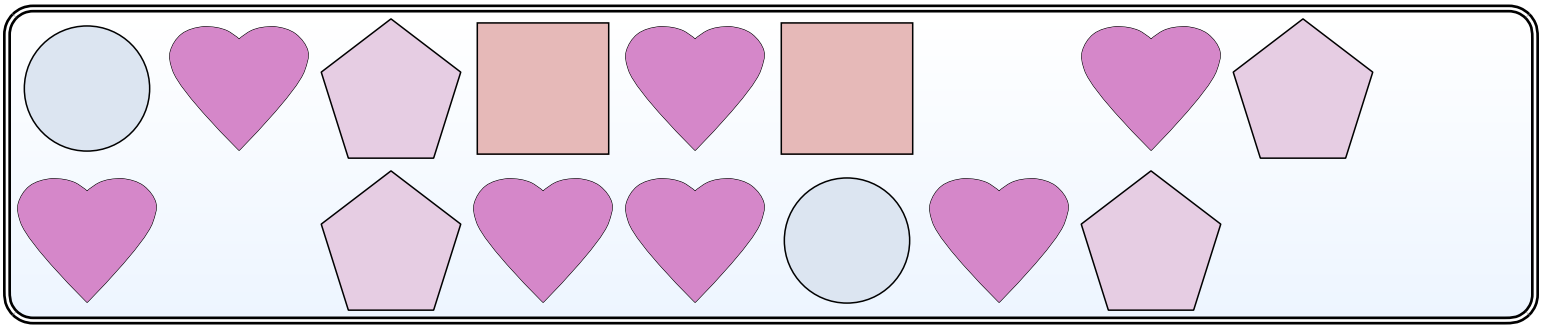

8) = 2

9) = 7

10) 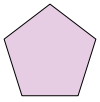 = 4

11) = 2

1-10	91	82	73	64	55	45	36	27	18	9
11	0									