Matching Tally to Bar Graphs

Name:

Match each table with the appropriate graph.

1)

Name	Cans Recycled
Allen	9
Beth	1
Rick	7
Andrea	2
Dale	7

2)

Name	Cans Recycled
Allen	3
Beth	4
Rick	3
Andrea	2
Dale	8

3)

Name	Cans Recycled
Allen	7
Beth	9
Rick	2
Andrea	8
Dale	7

4)

Name	Cans Recycled
Allen	4
Beth	5
Rick	5
Andrea	5
Dale	5

5)

Name	Cans Recycled
Allen	6
Beth	9
Rick	1
Andrea	7
Dale	8

6)

Name	Cans Recycled
Allen	7
Beth	7
Rick	9
Andrea	2
Dale	1

A.

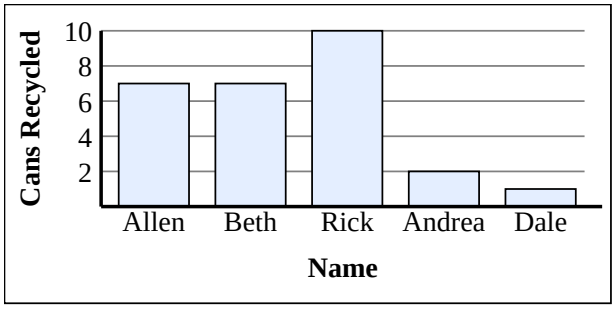

B.

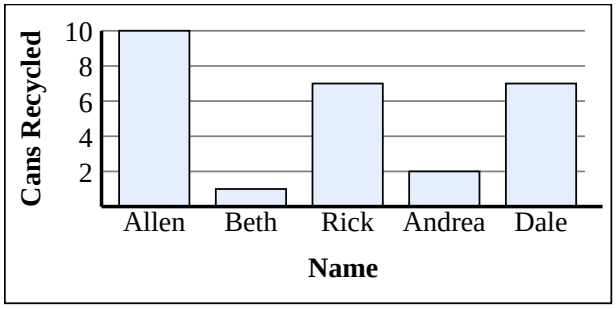

C.

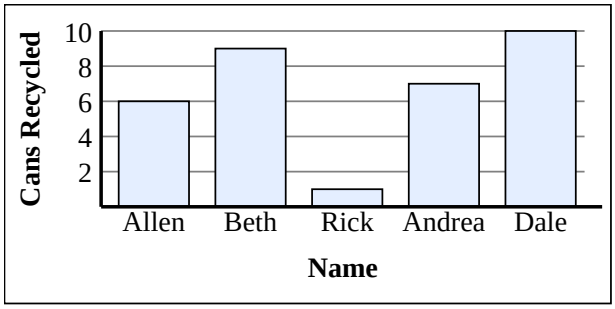

D.

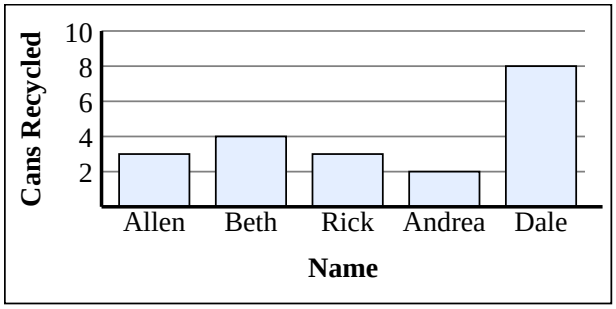

E.

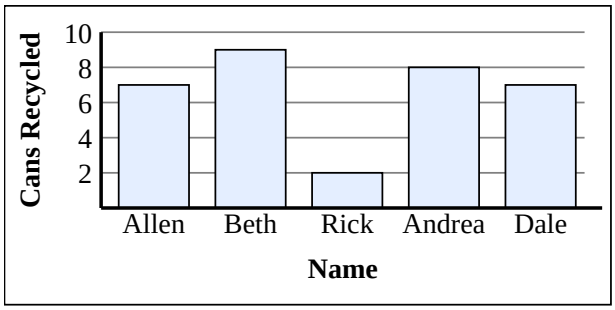

F.



Answers

1. _____
2. _____
3. _____
4. _____
5. _____
6. _____

1-6	83	67	50	33	17	0

Matching Tally to Bar Graphs

Name: **Answer Key**

Match each table with the appropriate graph.

1)

Name	Cans Recycled
Allen	9
Beth	1
Rick	7
Andrea	2
Dale	7

2)

Name	Cans Recycled
Allen	3
Beth	4
Rick	3
Andrea	2
Dale	8

3)

Name	Cans Recycled
Allen	7
Beth	9
Rick	2
Andrea	8
Dale	7

4)

Name	Cans Recycled
Allen	4
Beth	5
Rick	5
Andrea	5
Dale	5

5)

Name	Cans Recycled
Allen	6
Beth	9
Rick	1
Andrea	7
Dale	10

6)

Name	Cans Recycled
Allen	7
Beth	7
Rick	10
Andrea	2
Dale	1

A.

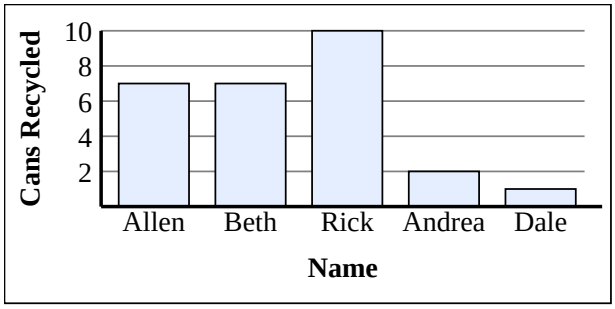

B.

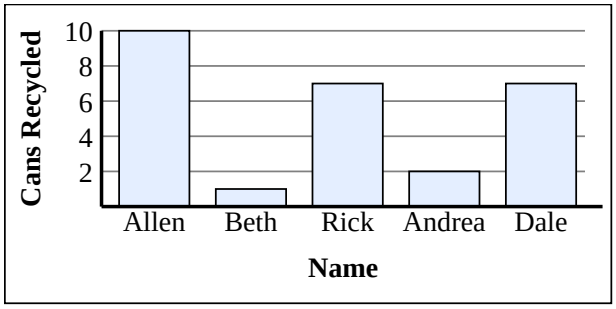

C.

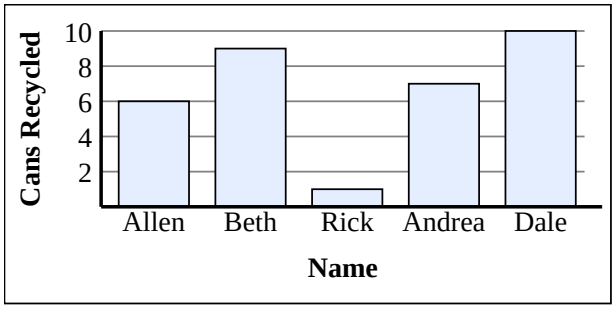

D.

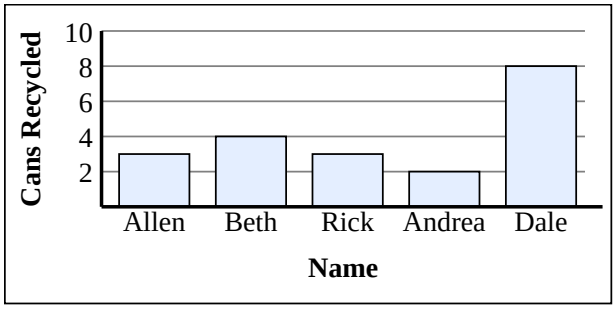

E.

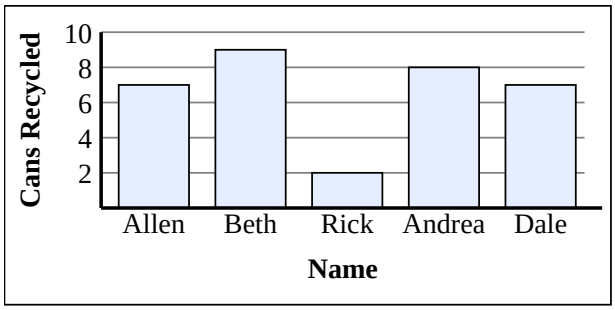

F.



Answers

1. **B**
2. **D**
3. **E**
4. **F**
5. **C**
6. **A**

1-6	83	67	50	33	17	0