Identifying Irregular Shapes Name:

Identify the type of shape shown.

1)

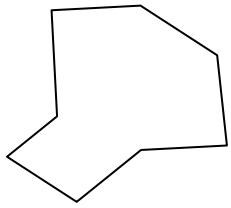

2)

3)

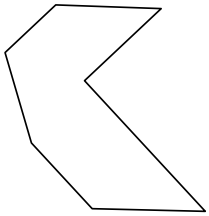

4)



5)

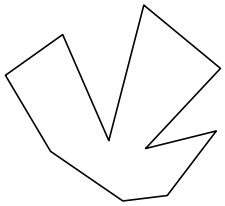

6)

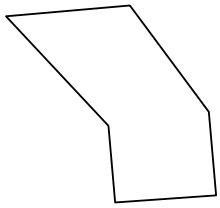

7)

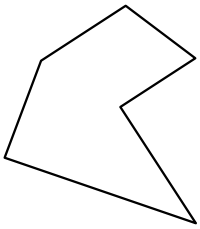

8)



9)

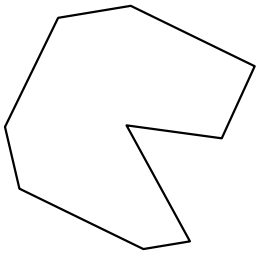

10)

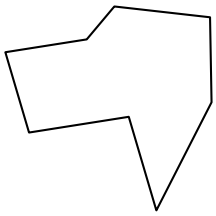

11)

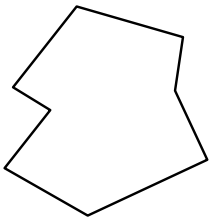

12)

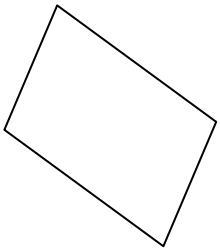

13)

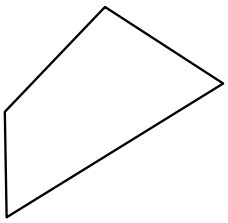

14)

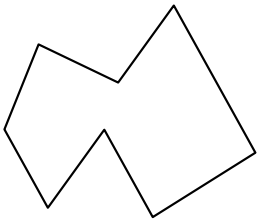

15)



16)

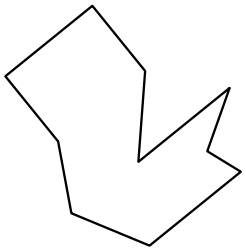

17)



18)

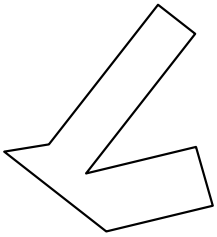

Answers

1. _____
2. _____
3. _____
4. _____
5. _____
6. _____
7. _____
8. _____
9. _____
10. _____
11. _____
12. _____
13. _____
14. _____
15. _____
16. _____
17. _____
18. _____
19. _____
20. _____
21.

1-10	93	87	80	73	67	60	53	47	40	33
11-15	27	20	13	7	0					

Identifying Irregular Shapes

Name: **Answer Key**

Identify the type of shape shown.

1)

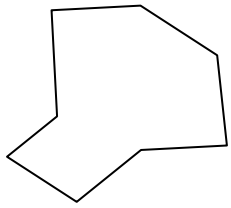

2)

3)

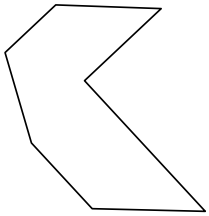

4)



5)

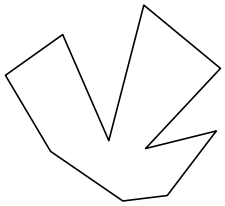

6)

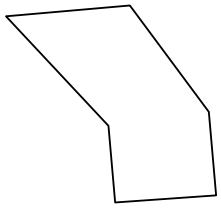

7)

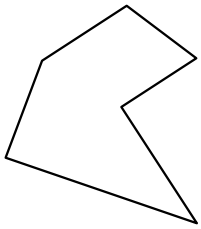

8)



9)

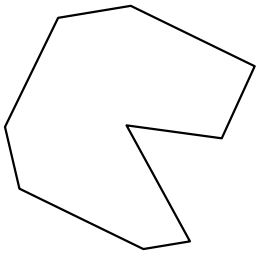

10)

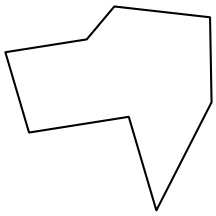

11)

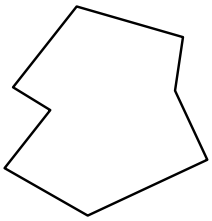

12)

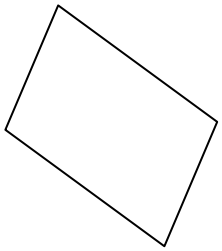

13)

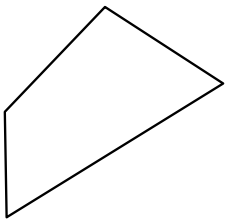

14)

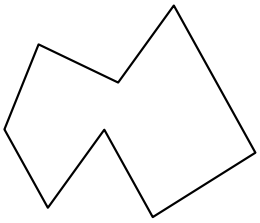

15)



16)

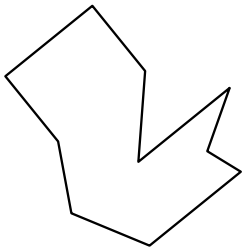

17)



18)

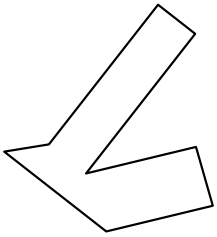

Answers

1. octagon
2. quadrilateral
3. heptagon
4. decagon
5. decagon
6. hexagon
7. hexagon
8. pentagon
9. nonagon
10. octagon
11. octagon
12. quadrilateral
13. quadrilateral
14. octagon
15. nonagon
16. decagon
17. octagon
18. octagon
19. quadrilateral
20. heptagon
21. nonagon

1-10	93	87	80	73	67	60	53	47	40	33
11-15	27	20	13	7	0					