Identifying Shapes

Name:

Determine if the figure shown is a 'Triangle', 'Square', 'Rectangle', 'Hexagon' or 'Other'.

1)

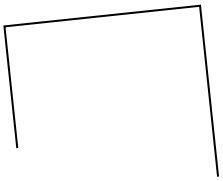

2)

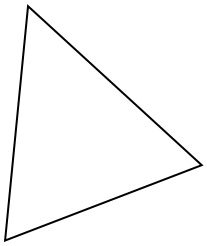

3)

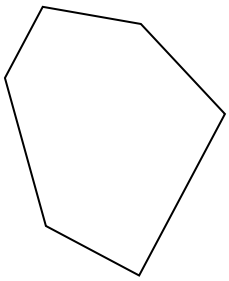

4)

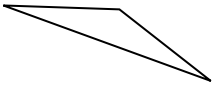

5)

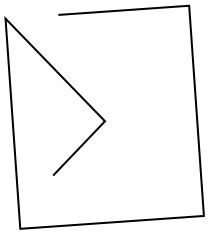

6)



7)

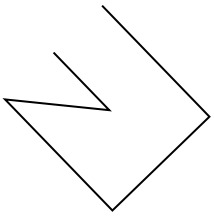

8)



9)

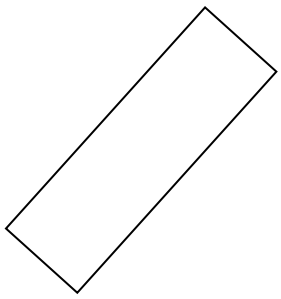

10)

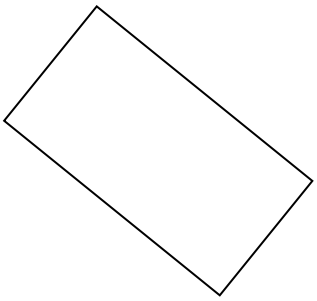

11)

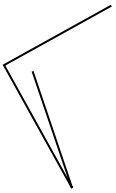

12)



13)

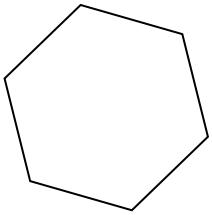

14)

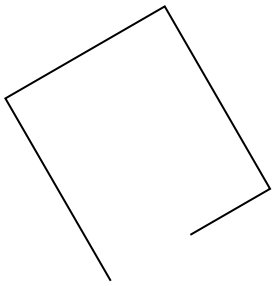

15)

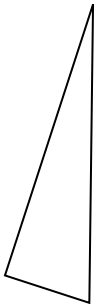

Answers

1. _____
2. _____
3. _____
4. _____
5. _____
6. _____
7. _____
8. _____
9. _____
10. _____
11. _____
12. _____
13. _____
14. _____
15. _____

1-10	93	87	80	73	67	60	53	47	40	33
11-15	27	20	13	7	0					

Identifying Shapes

Name: **Answer Key**

Determine if the figure shown is a 'Triangle', 'Square', 'Rectangle', 'Hexagon' or 'Other'.

1)

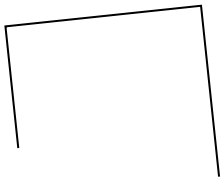

2)

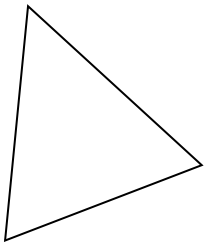

3)

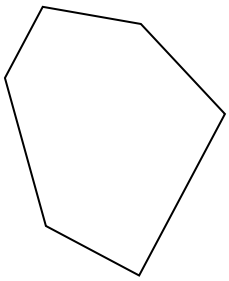

4)

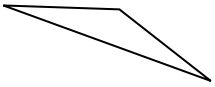

5)

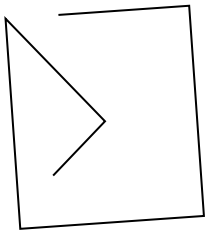

6)



7)

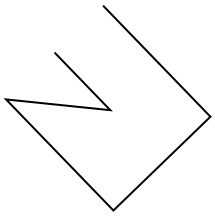

8)



9)

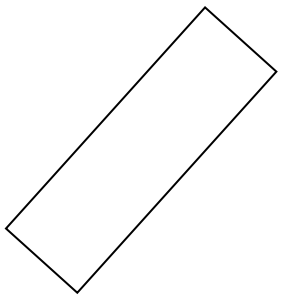

10)

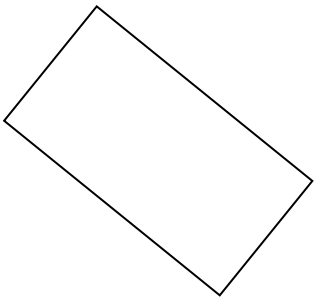

11)

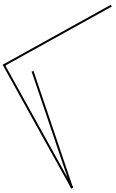

12)



13)

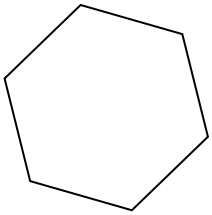

14)

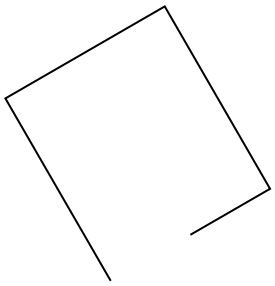

15)

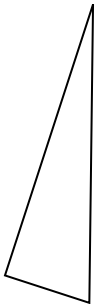

Answers

1. other
2. triangle
3. hexagon
4. triangle
5. other
6. hexagon
7. other
8. square
9. rectangle
10. rectangle
11. other
12. other
13. hexagon
14. other
15. triangle

1-10	93	87	80	73	67	60	53	47	40	33
11-15	27	20	13	7	0					