Determine which letter BEST represents the shapes that were used to create the figure shown.

1)

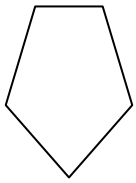

A. hexagon & triangle
B. quadrilateral & triangle
C. rectangle & pentagon
D. rectangle & octagon

2)

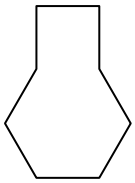

A. pentagon & square
B. square & heptagon
C. hexagon & square
D. square & triangle

3)

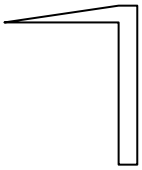

A. quadrilateral & triangle
B. square & quadrilateral
C. heptagon & octagon
D. hexagon & heptagon

4)

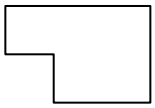

A. rectangle & square
B. hexagon & square
C. quadrilateral & octagon
D. rectangle & triangle

5)



A. triangle & triangle
B. rectangle & hexagon
C. pentagon & quadrilateral
D. rectangle & quadrilateral

6)

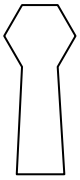

A. quadrilateral & hexagon
B. quadrilateral & heptagon
C. hexagon & quadrilateral
D. quadrilateral & triangle

7)

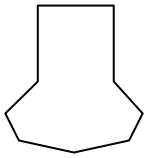

A. heptagon & rectangle
B. square & rectangle
C. heptagon & quadrilateral
D. pentagon & octagon

8)

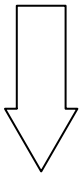

A. hexagon & octagon
B. octagon & square
C. triangle & pentagon
D. rectangle & triangle

Answers

1. _____
2. _____
3. _____
4. _____
5. _____
6. _____
7. _____
8. _____

1-8	88	75	63	50	38	25	13	0

Determine which letter BEST represents the shapes that were used to create the figure shown.

1)

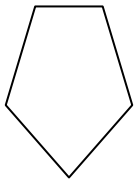

A. hexagon & triangle
B. quadrilateral & triangle
C. rectangle & pentagon
D. rectangle & octagon

2)

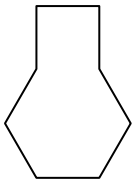

A. pentagon & square
B. square & heptagon
C. hexagon & square
D. square & triangle

3)

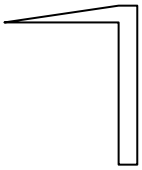

A. quadrilateral & triangle
B. square & quadrilateral
C. heptagon & octagon
D. hexagon & heptagon

4)

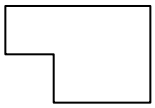

A. rectangle & square
B. hexagon & square
C. quadrilateral & octagon
D. rectangle & triangle

5)



A. triangle & triangle
B. rectangle & hexagon
C. pentagon & quadrilateral
D. rectangle & quadrilateral

6)

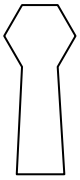

A. quadrilateral & hexagon
B. quadrilateral & heptagon
C. hexagon & quadrilateral
D. quadrilateral & triangle

7)

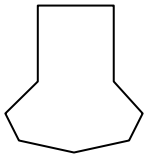

A. heptagon & rectangle
B. square & rectangle
C. heptagon & quadrilateral
D. pentagon & octagon

8)

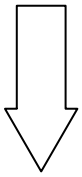

A. hexagon & octagon
B. octagon & square
C. triangle & pentagon
D. rectangle & triangle

Answers

1. **B**
2. **C**
3. **A**
4. **A**
5. **A**
6. **C**
7. **C**
8. **D**

1-8	88	75	63	50	38	25	13	0