Function Machines (Add & Subtract) Name:

Determine the rule each function machine is using.

Ex)

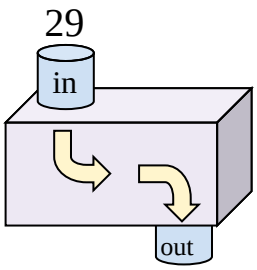

Subtract 13

1)

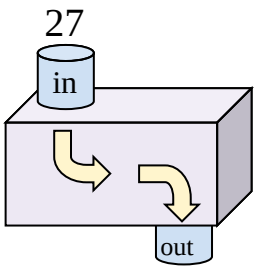

2)

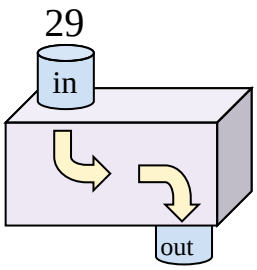

3)

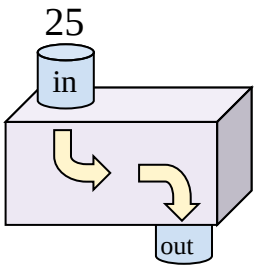

4)

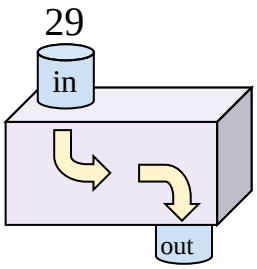

5)

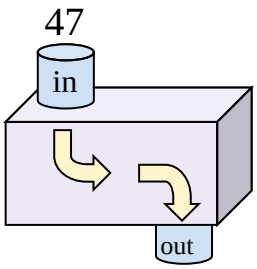

6)

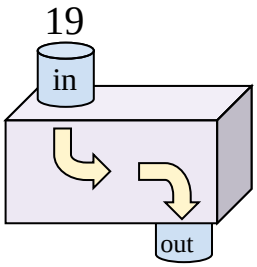

7)

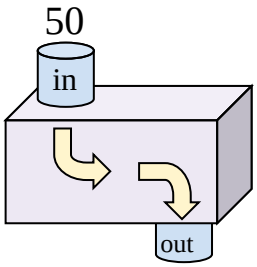

8)

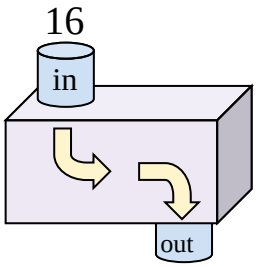

9)

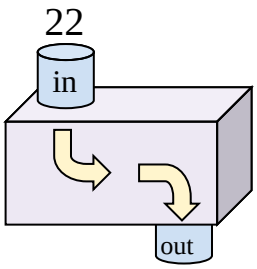

10)

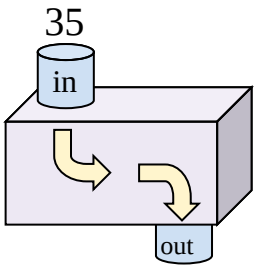

11)

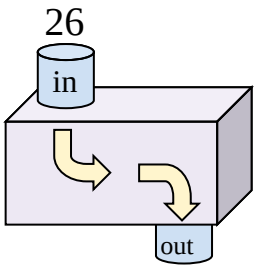

Answers

Ex. Subtract 13

1. _____
2. _____
3. _____
4. _____
5. _____
6. _____
7. _____
8. _____
9. _____
10. _____
11. _____

Function Machines (Add & Subtract) Name: **Answer Key**

Determine the rule each function machine is using.

Ex)

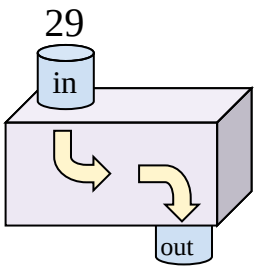

Subtract 13

1)

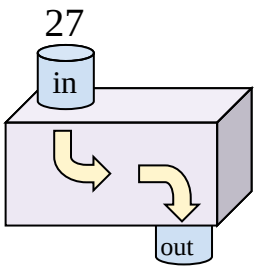

Add 11

2)

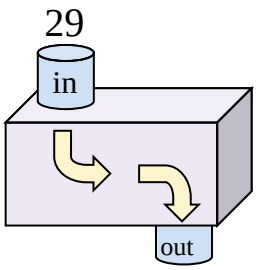

Add 21

3)

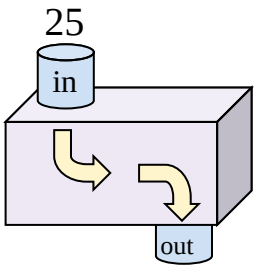

Add 18

4)

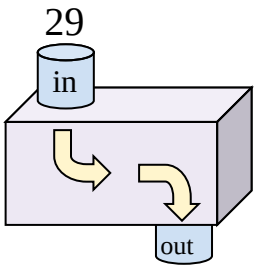

Add 17

5)

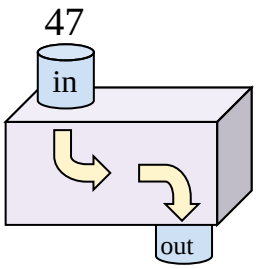

Subtract 21

6)

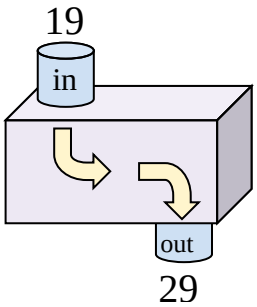

Add 10

7)

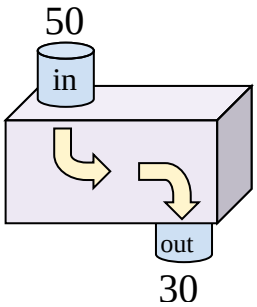

Subtract 20

8)

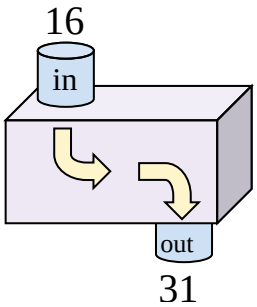

Add 15

9)

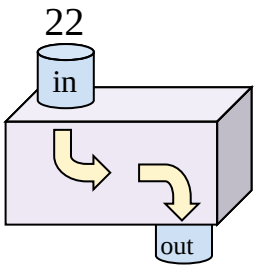

Add 12

10)

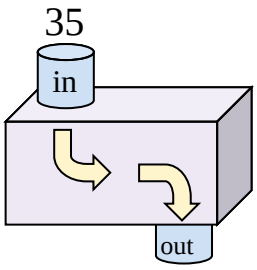

Subtract 27

11)

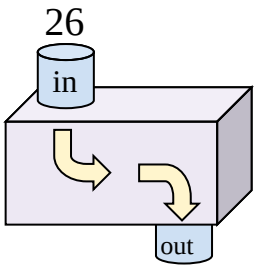

Subtract 17

Answers

Ex.	Subtract 13
1.	Add 11
2.	Add 21
3.	Add 18
4.	Add 17
5.	Subtract 21
6.	Add 10
7.	Subtract 20
8.	Add 15
9.	Add 12
10.	Subtract 27
11.	Subtract 17