Function Machines (Add & Subtract) Name:

Determine the rule each function machine is using.

Ex)

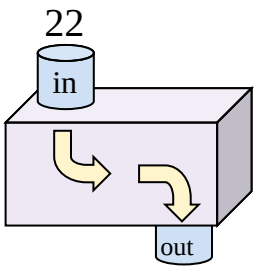

Add 20

1)

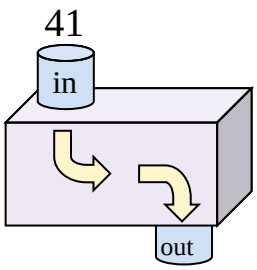

2)

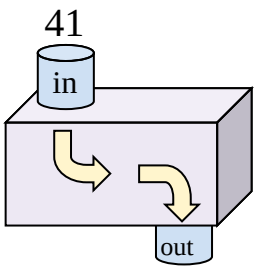

3)

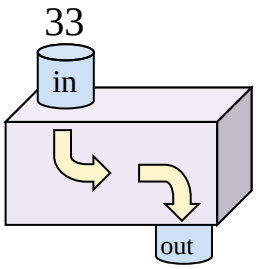

4)

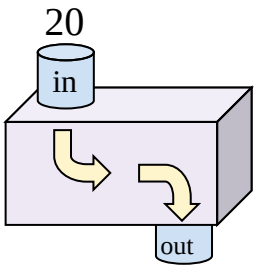

5)

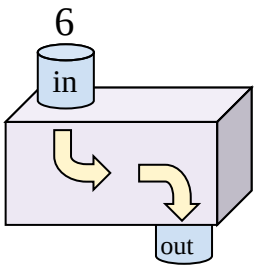

6)

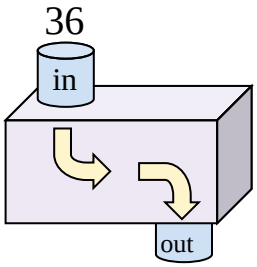

7)

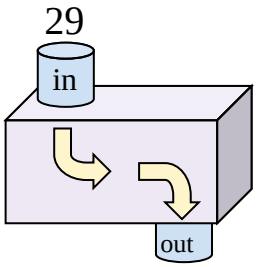

8)

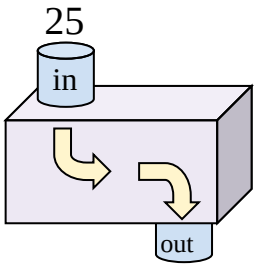

9)

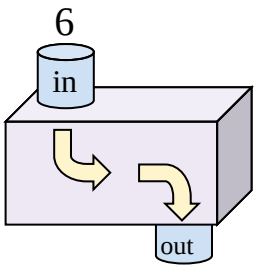

10)

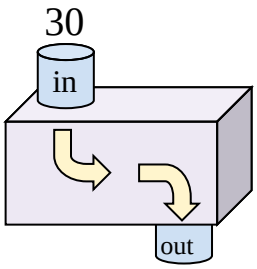

11)

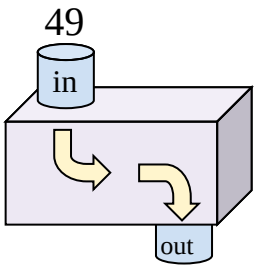

Answers

Ex. Add 20

1. _____
2. _____
3. _____
4. _____
5. _____
6. _____
7. _____
8. _____
9. _____
10. _____
11. _____

1-10	91	82	73	64	55	45	36	27	18	9
11	0									

Function Machines (Add & Subtract) Name: **Answer Key**

Determine the rule each function machine is using.

Ex)

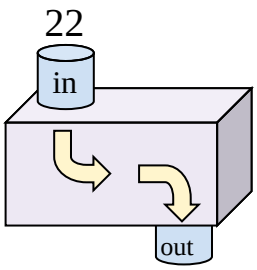

Add 20

1)

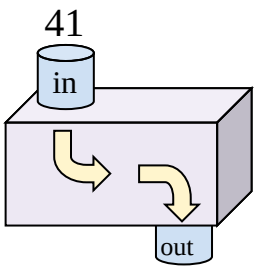

Subtract 18

2)

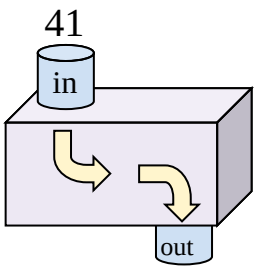

Subtract 33

3)

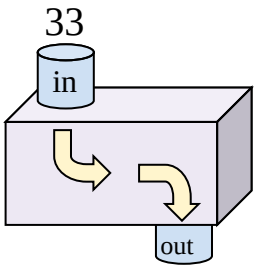

Subtract 16

4)

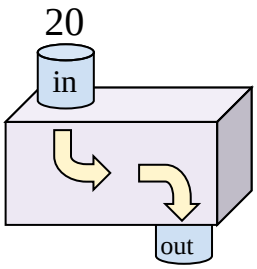

Subtract 8

5)

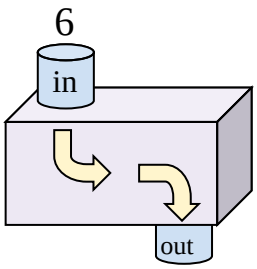

Add 37

6)

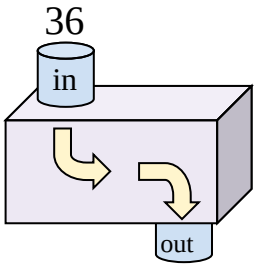

Subtract 11

7)

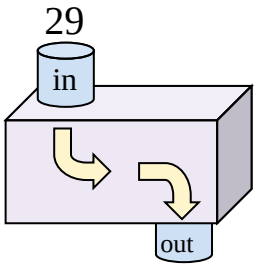

Add 15

8)

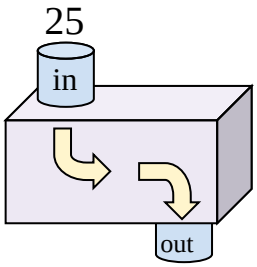

Add 25

9)

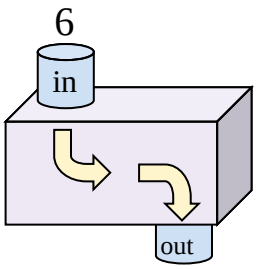

Add 10

10)

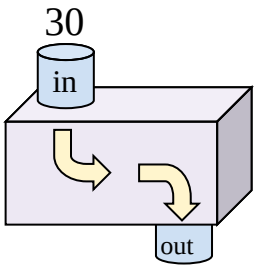

Subtract 16

11)

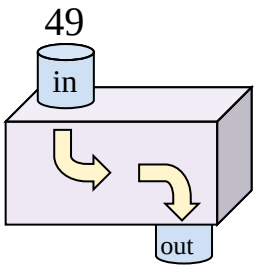

Subtract 29

Answers

Ex. **Add 20**

1. **Subtract 18**
2. **Subtract 33**
3. **Subtract 16**
4. **Subtract 8**
5. **Add 37**
6. **Subtract 11**
7. **Add 15**
8. **Add 25**
9. **Add 10**
10. **Subtract 16**
11. **Subtract 29**

1-10	91	82	73	64	55	45	36	27	18	9
11	0									