Rewriting Multiplication Problems (visual)

Name:

Write each array as a multiplication problem and solve.

Ex)



1)

2)



3)

4)



5)



6)



7)



8)



9)

10)



11)

Answers

Ex. 7 × 7 = 49

1. _____
2. _____
3. _____
4. _____
5. _____
6. _____
7. _____
8. _____
9. _____
10. _____
11. _____

1-10	91	82	73	64	55	45	36	27	18	9
11	0									

Rewriting Multiplication Problems (visual) Name: **Answer Key**

Write each array as a multiplication problem and solve.

Ex)



1)

2)



3)

4)



5)



6)



7)



8)



9)

10)



11)

Answers

Ex. 7 × 7 = 49

1. 8 × 6 = 48

2. 6 × 8 = 48

3. 5 × 2 = 10

4. 10 × 8 = 80

5. 8 × 2 = 16

6. 9 × 10 = 90

7. 3 × 8 = 24

8. 8 × 9 = 72

9. 3 × 9 = 27

10. 9 × 9 = 81

11. 6 × 4 = 24

1-10	91	82	73	64	55	45	36	27	18	9
11	0									