Rewriting Multiplication Problems (visual)

Name:

Write each array as a multiplication problem and solve.

Ex)



1)



2)

3)



4)

5)



6)

7)

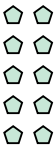

8)

9)

10)



11)

Answers

Ex. 10 × 10 = 100

1. _____
2. _____
3. _____
4. _____
5. _____
6. _____
7. _____
8. _____
9. _____
10. _____
11. _____

1-10	91	82	73	64	55	45	36	27	18	9
11	0									

Rewriting Multiplication Problems (visual) Name: **Answer Key**

Write each array as a multiplication problem and solve.

Ex)



1)



2)

3)



4)

5)



6)

7)

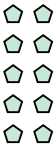

8)

9)

10)



11)

Answers

Ex. 10 × 10 = 100

1. 10 × 7 = 70
2. 4 × 7 = 28
3. 10 × 6 = 60
4. 8 × 2 = 16
5. 3 × 6 = 18
6. 6 × 2 = 12
7. 5 × 2 = 10
8. 5 × 7 = 35
9. 5 × 5 = 25
10. 9 × 9 = 81
11. 3 × 8 = 24

1-10	91	82	73	64	55	45	36	27	18	9
11	0									