# Rewriting Multiplication Problems (visual)

Name:

**Write each array as a multiplication problem and solve.**

**Ex)**

**1)**



**2)**

**3)**

**4)**

**5)**



**6)**

**7)**

**8)**

**9)**



**10)**

**11)**



## Answers

Ex. **6 × 3 = 18**

1. _____
2. _____
3. _____
4. _____
5. _____
6. _____
7. _____
8. _____
9. _____
10. _____
11. _____



| | | | | | | | | | | |
|---|---|---|---|---|---|---|---|---|---|---|
| 1-10 | 91 | 82 | 73 | 64 | 55 | 45 | 36 | 27 | 18 | 9 |
| 11 | 0 | | | | | | | | | |

Rewriting Multiplication Problems (visual) Name: **Answer Key**

**Write each array as a multiplication problem and solve.**

**Ex)**

**1)** 

**2)**

**3)**

**4)**

**5)** 

**6)**

**7)**

**8)**

**9)** 

**10)**

**11)** 

## Answers

Ex. 6 × 3 = 18

1. 10 × 9 = 90
2. 9 × 5 = 45
3. 5 × 2 = 10
4. 8 × 4 = 32
5. 9 × 10 = 90
6. 3 × 2 = 6
7. 4 × 9 = 36
8. 10 × 3 = 30
9. 10 × 7 = 70
10. 2 × 8 = 16
11. 3 × 4 = 12



| | | | | | | | | | | |
|---|---|---|---|---|---|---|---|---|---|---|
| 1-10 | 91 | 82 | 73 | 64 | 55 | 45 | 36 | 27 | 18 | 9 |
| 11 | 0 | | | | | | | | | |