# Finding Distance on a Grid

Name:

**Find the distance between points. Round your answer to the nearest tenth.**

**Ex)**

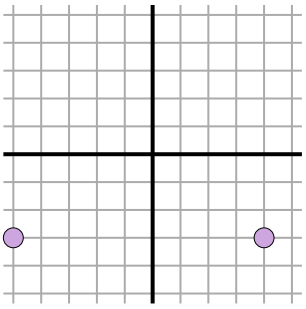

**1)**

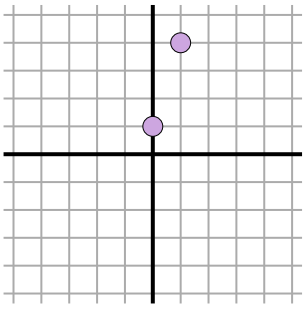

**2)**

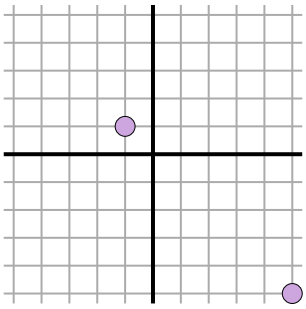

**3)**

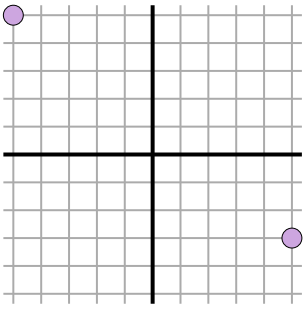

**4)**

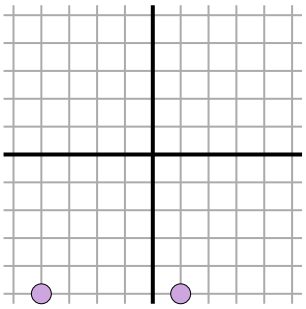

**5)**

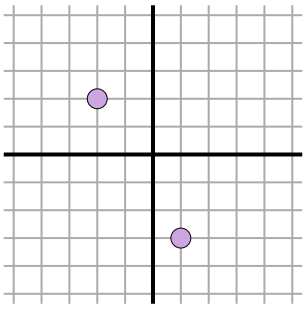

**6)**

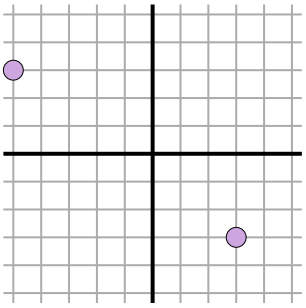

**7)**

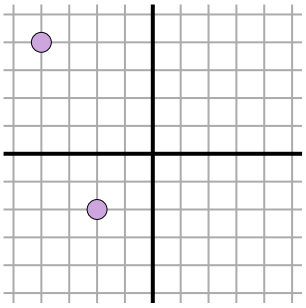

**8)**

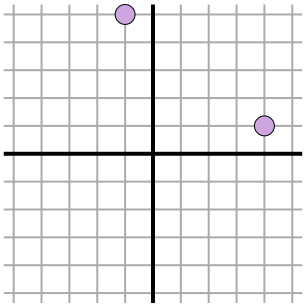

**9)**

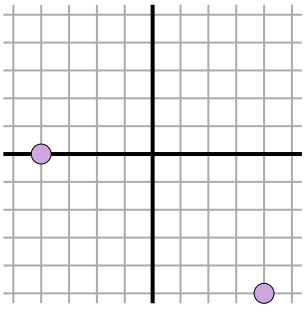

**10)**

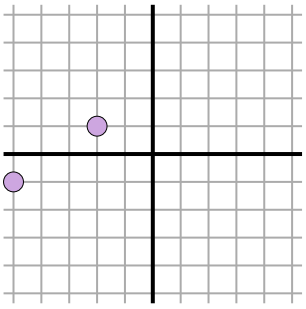

**11)**

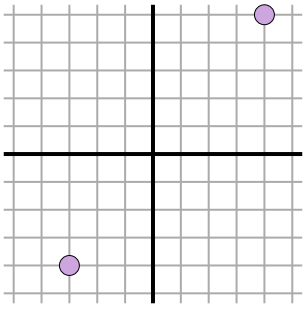

## Answers

Ex. 9

1. _____
2. _____
3. _____
4. _____
5. _____
6. _____
7. _____
8. _____
9. _____
10. _____
11. _____



| | | | | | | | | | | |
|---|---|---|---|---|---|---|---|---|---|---|
| 1-10 | 91 | 82 | 73 | 64 | 55 | 45 | 36 | 27 | 18 | 9 |
| 11 | 0 | | | | | | | | | |

Finding Distance on a Grid

Name: **Answer Key**

**Find the distance between points. Round your answer to the nearest tenth.**

**Ex)**

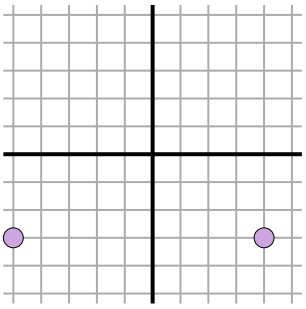

$\sqrt{(-5-4)^2 + (-3--3)^2}$

$\sqrt{(81) + (0)}$

**1)**

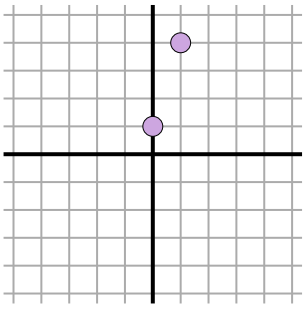

$\sqrt{(1-0)^2 + (4-1)^2}$

$\sqrt{(1) + (9)}$

**2)**

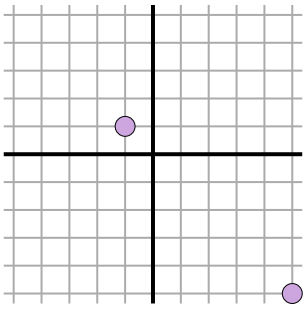

$\sqrt{(-1-5)^2 + (1--5)^2}$

$\sqrt{(36) + (36)}$

**3)**

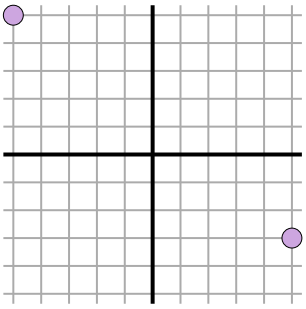

$\sqrt{(5--5)^2 + (-3-5)^2}$

$\sqrt{(100) + (64)}$

**4)**

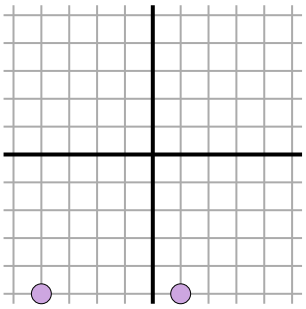

$\sqrt{(1--4)^2 + (-5--5)^2}$

$\sqrt{(25) + (0)}$

**5)**

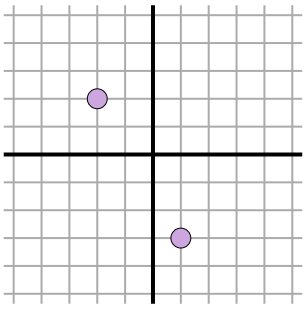

$\sqrt{(-2-1)^2 + (2--3)^2}$

$\sqrt{(9) + (25)}$

**6)**

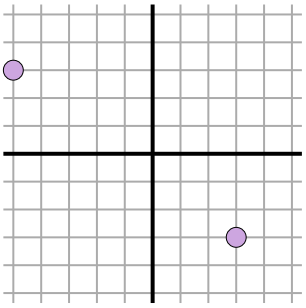

$\sqrt{(-5-3)^2 + (3--3)^2}$

$\sqrt{(64) + (36)}$

**7)**

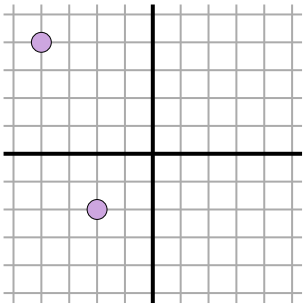

$\sqrt{(-4--2)^2 + (4--2)^2}$

$\sqrt{(4) + (36)}$

**8)**

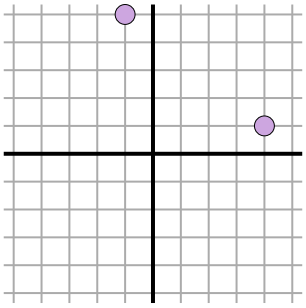

$\sqrt{(-1-4)^2 + (5-1)^2}$

$\sqrt{(25) + (16)}$

**9)**

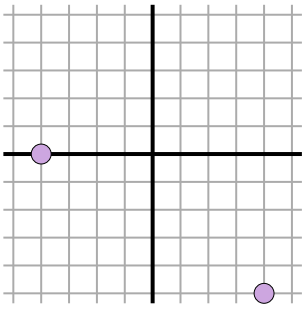

$\sqrt{(-4-4)^2 + (0--5)^2}$

$\sqrt{(64) + (25)}$

**10)**

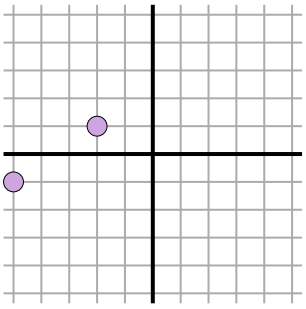

$\sqrt{(-2--5)^2 + (1--1)^2}$

$\sqrt{(9) + (4)}$

**11)**

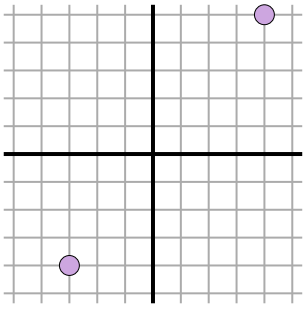

$\sqrt{(-3-4)^2 + (-4-5)^2}$

$\sqrt{(49) + (81)}$

## Answers

| | |
|---|---|
| Ex. | 9 |
| 1. | 3.2 |
| 2. | 8.5 |
| 3. | 12.8 |
| 4. | 5 |
| 5. | 5.8 |
| 6. | 10 |
| 7. | 6.3 |
| 8. | 6.4 |
| 9. | 9.4 |
| 10. | 3.6 |
| 11. | 11.4 |



| | | | | | | | | | | |
|---|---|---|---|---|---|---|---|---|---|---|
| 1-10 | 91 | 82 | 73 | 64 | 55 | 45 | 36 | 27 | 18 | 9 |
| 11 | 0 | | | | | | | | | |