Partitioning and Labeling Numberline Fractions

Name:

Solve each problem.

1) Partition into 4 equal pieces and label each partition.

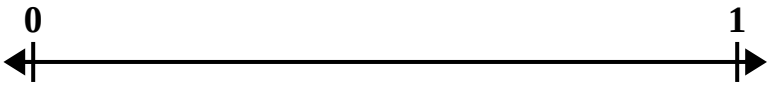

2) Partition into 8 equal pieces and label each partition.



3) Partition into 6 equal pieces and label each partition.



4) Partition into 3 equal pieces and label each partition.



5) Partition into 2 equal pieces and label each partition.



Partitioning and Labeling Numberline Fractions Name: **Answer Key**

Solve each problem.

1) Partition into 4 equal pieces and label each partition.

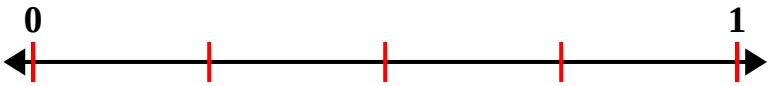

2) Partition into 8 equal pieces and label each partition.

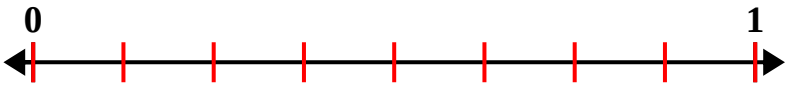

3) Partition into 6 equal pieces and label each partition.

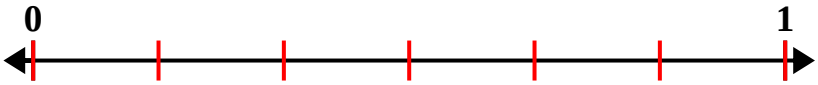

4) Partition into 3 equal pieces and label each partition.



5) Partition into 2 equal pieces and label each partition.

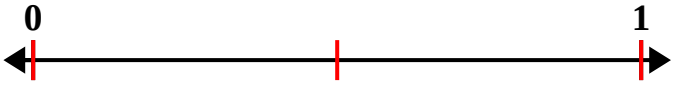

1-5	80	60	40	20	0