Comparing Fractions Name:

Determine which fraction goes in the middle to make the comparison true.

1) $^{2}/_{4}$ < ? < $^{6}/_{8}$

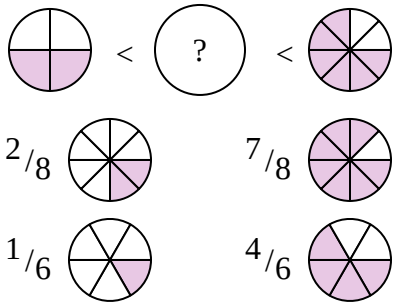

2) $^{2}/_{6}$ < ? < $^{2}/_{3}$

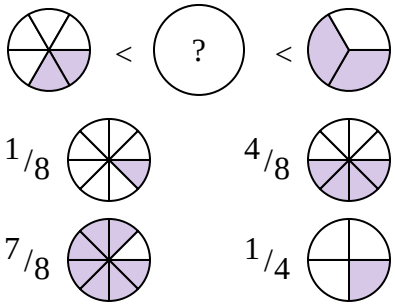

3) $^{5}/_{8}$ < ? < $^{6}/_{8}$

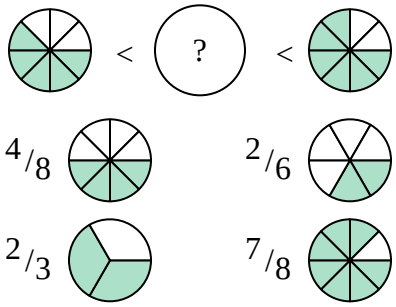

4) $^{1}/_{4}$ < ? < $^{3}/_{8}$

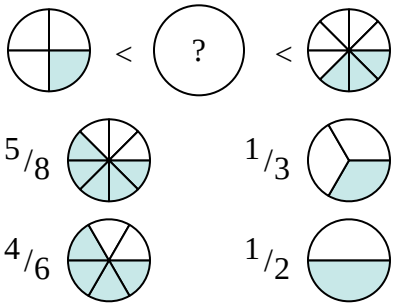

5) $^{1}/_{8}$ < ? < $^{1}/_{2}$

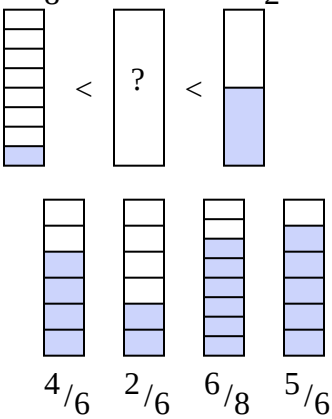

6) $^{3}/_{6}$ < ? < $^{2}/_{3}$

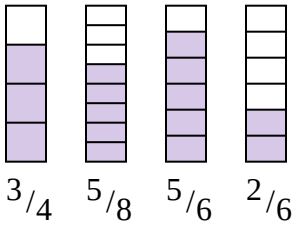

7) $^{1}/_{8}$ < ? < $^{3}/_{6}$

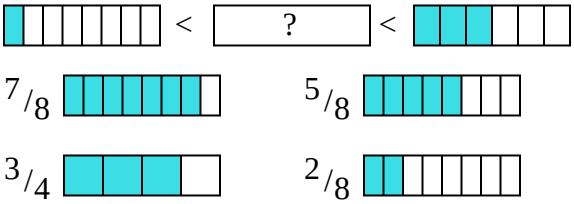

8) $^{4}/_{8}$ < ? < $^{5}/_{6}$

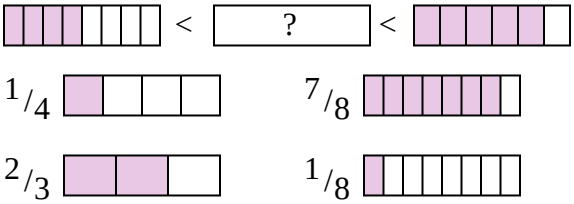

Answers

1. _____
2. _____
3. _____
4. _____
5. _____
6. _____
7. _____
8. _____

1-8	88	75	63	50	38	25	13	0

Comparing Fractions

Name: **Answer Key**

Determine which fraction goes in the middle to make the comparison true.

1) $^{2}/_{4}$ < ? < $^{6}/_{8}$

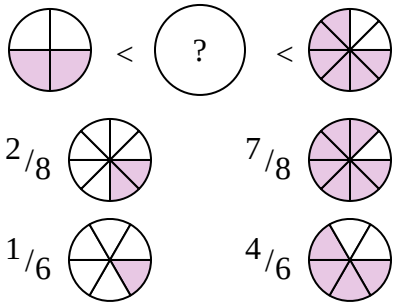

2) $^{2}/_{6}$ < ? < $^{2}/_{3}$

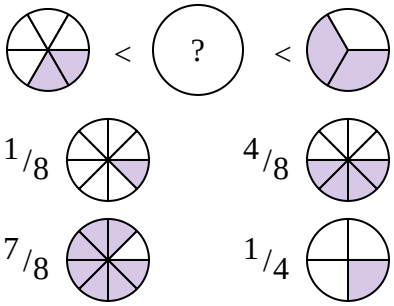

3) $^{5}/_{8}$ < ? < $^{6}/_{8}$

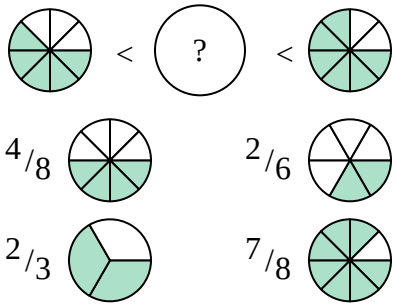

4) $^{1}/_{4}$ < ? < $^{3}/_{8}$

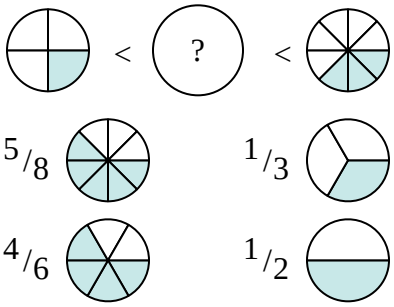

5) $^{1}/_{8}$ < ? < $^{1}/_{2}$

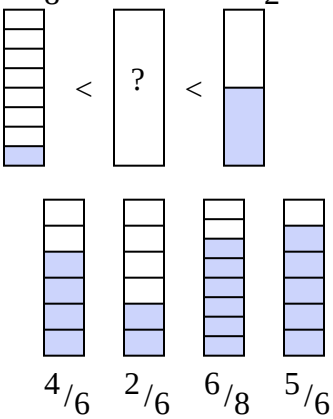

6) $^{3}/_{6}$ < ? < $^{2}/_{3}$

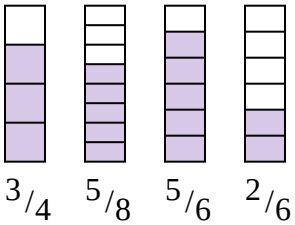

7) $^{1}/_{8}$ < ? < $^{3}/_{6}$

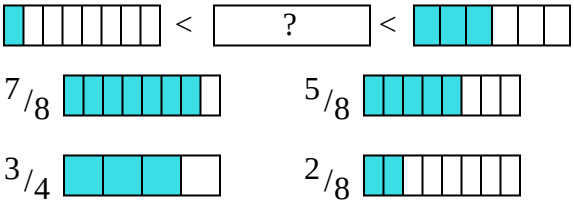

8) $^{4}/_{8}$ < ? < $^{5}/_{6}$

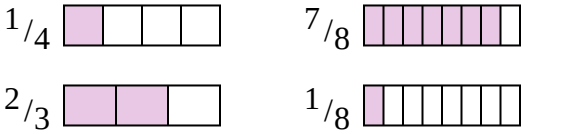

Answers

1. $^{4}/_{6}$
2. $^{4}/_{8}$
3. $^{2}/_{3}$
4. $^{1}/_{3}$
5. $^{2}/_{6}$
6. $^{5}/_{8}$
7. $^{2}/_{8}$
8. $^{2}/_{3}$

1-8	88	75	63	50	38	25	13	0