Dividing with a Numberline

Name:

Use the numberline to solve each problem. The first is marked for you.

1) $7 \div \frac{2}{3}$

2) $7 \div \frac{3}{4}$

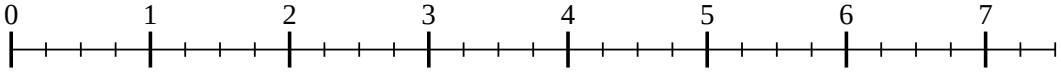

3) $4 \div \frac{3}{4}$

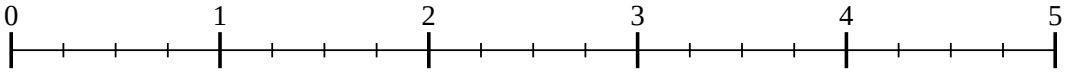

4) $5 \div \frac{3}{5}$

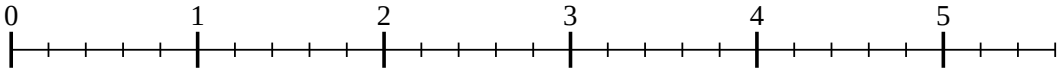

5) $6 \div \frac{2}{3}$

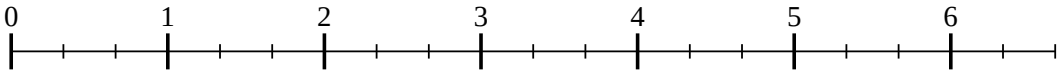

6) $3 \div \frac{3}{5}$

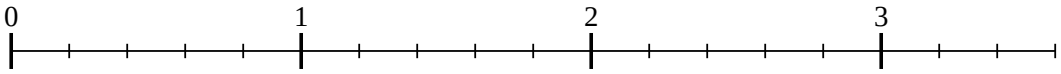

7) $5 \div \frac{2}{6}$

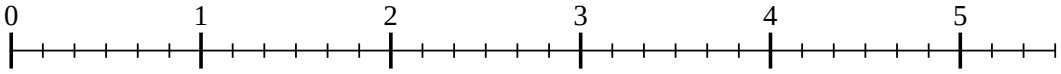

8) $5 \div \frac{3}{4}$

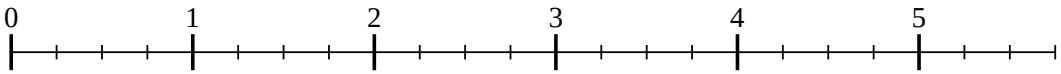

9) $2 \div \frac{2}{6}$

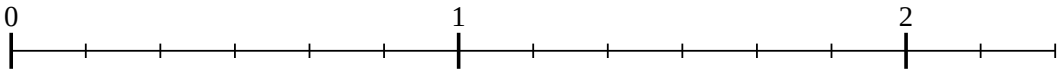

Answers

1. _____
2. _____
3. _____
4. _____
5. _____
6. _____
7. _____
8. _____
9. _____

1-9	89	78	67	56	44	33	22	11	0

Dividing with a Numberline

Name: **Answer Key**

Use the numberline to solve each problem. The first is marked for you.

1) $7 \div \frac{2}{3}$

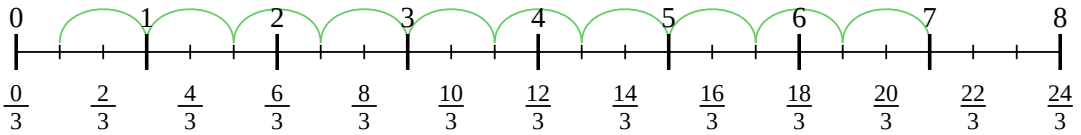

2) $7 \div \frac{3}{4}$

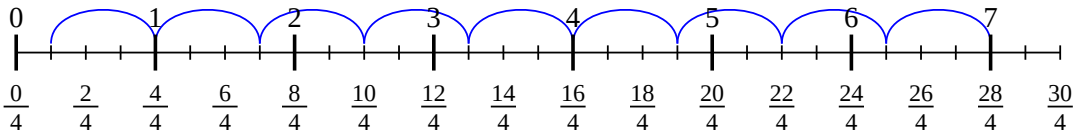

3) $4 \div \frac{3}{4}$

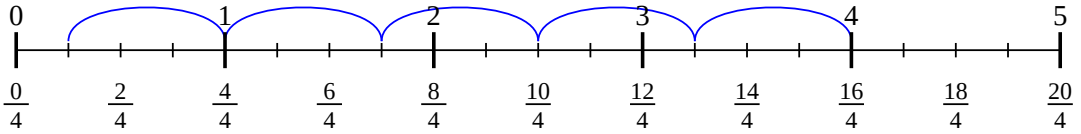

4) $5 \div \frac{3}{5}$

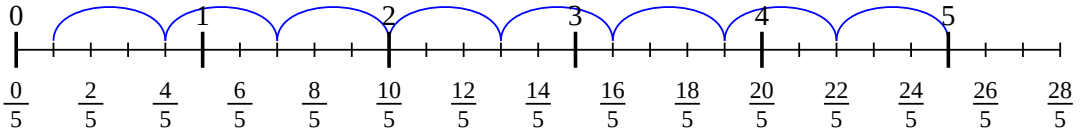

5) $6 \div \frac{2}{3}$

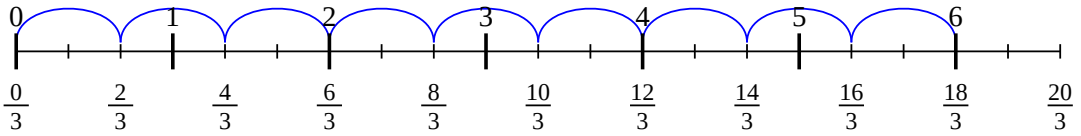

6) $3 \div \frac{3}{5}$

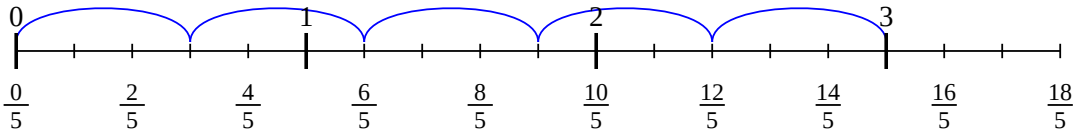

7) $5 \div \frac{2}{6}$

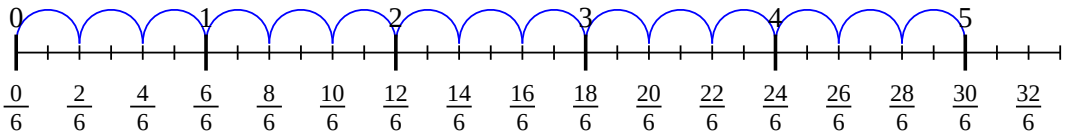

8) $5 \div \frac{3}{4}$

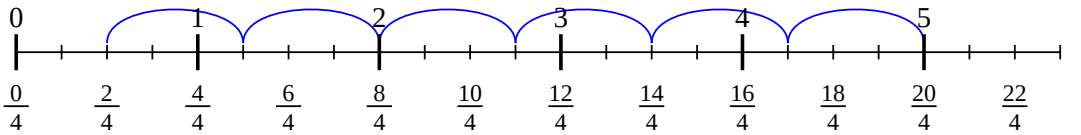

9) $2 \div \frac{2}{6}$

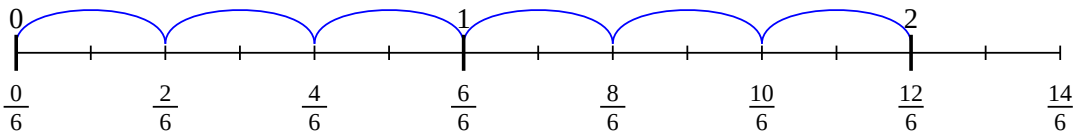

Answers

1. $\frac{21}{2}$
2. $\frac{28}{3}$
3. $\frac{16}{3}$
4. $\frac{25}{3}$
5. $\frac{18}{2}$
6. $\frac{15}{3}$
7. $\frac{30}{2}$
8. $\frac{20}{3}$
9. $\frac{12}{2}$

1-9	89	78	67	56	44	33	22	11	0