Dividing with a Numberline Name:

Use the numberline to solve each problem. The first is marked for you.

1) $4 \div \frac{2}{6}$

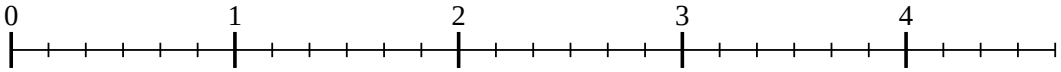

2) $3 \div \frac{5}{6}$

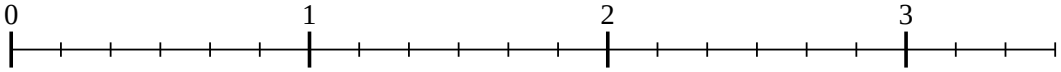

3) $2 \div \frac{3}{6}$

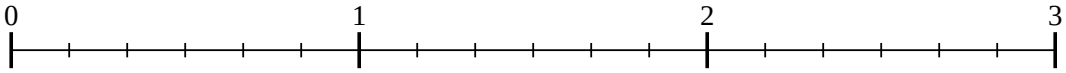

4) $2 \div \frac{2}{4}$

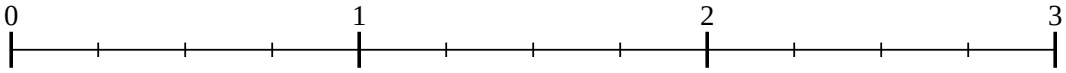

5) $6 \div \frac{3}{4}$

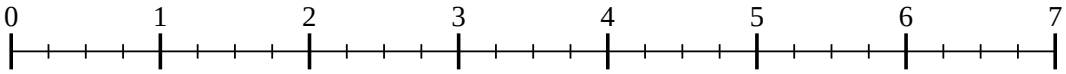

6) $7 \div \frac{2}{5}$

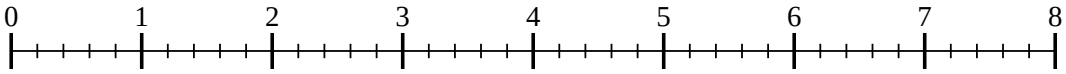

7) $7 \div \frac{3}{6}$

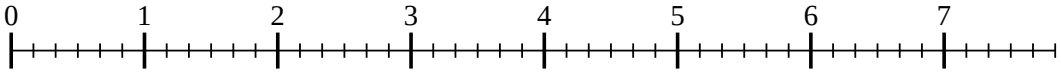

8) $4 \div \frac{3}{4}$

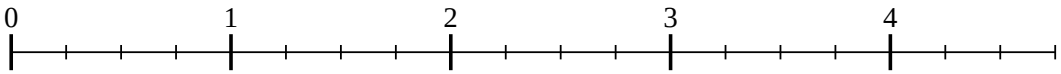

9) $4 \div \frac{4}{5}$

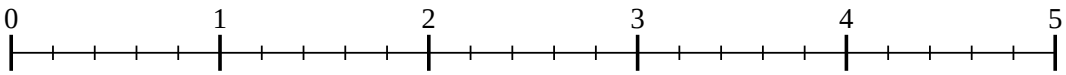

Answers

1. _____
2. _____
3. _____
4. _____
5. _____
6. _____
7. _____
8. _____
9. _____

1-9	89	78	67	56	44	33	22	11	0

Dividing with a Numberline Name: **Answer Key**

Use the numberline to solve each problem. The first is marked for you.

1) $4 \div \frac{2}{6}$

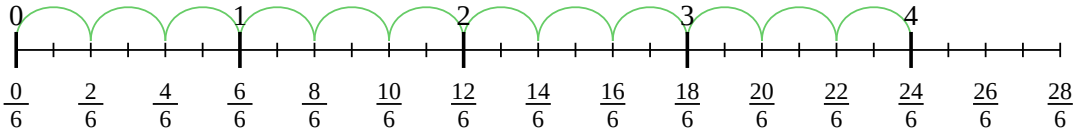

2) $3 \div \frac{5}{6}$

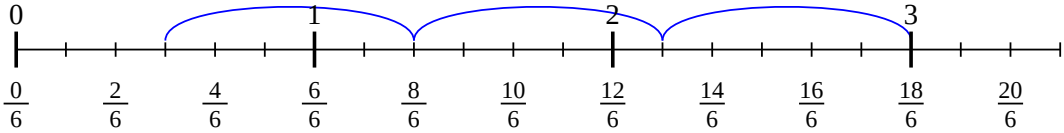

3) $2 \div \frac{3}{6}$

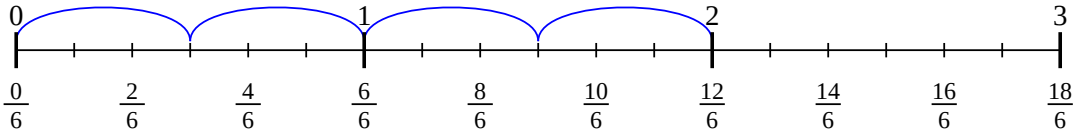

4) $2 \div \frac{2}{4}$

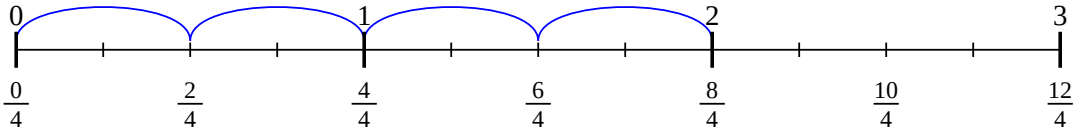

5) $6 \div \frac{3}{4}$

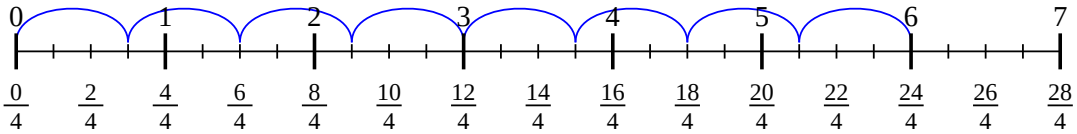

6) $7 \div \frac{2}{5}$

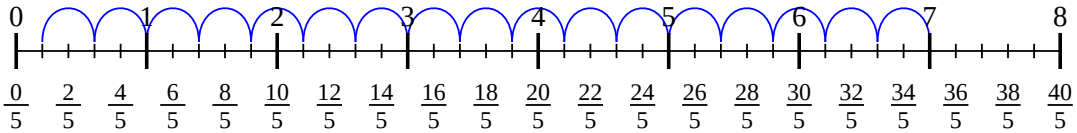

7) $7 \div \frac{3}{6}$

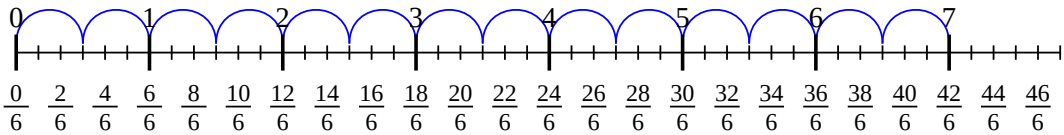

8) $4 \div \frac{3}{4}$

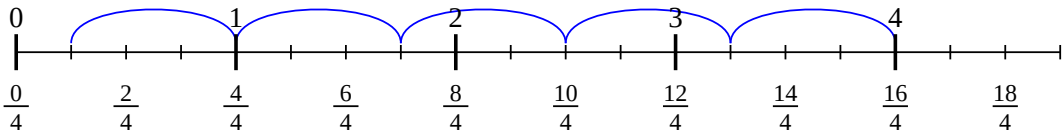

9) $4 \div \frac{4}{5}$

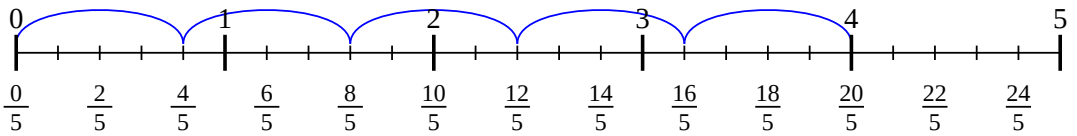

Answers

1. $24/2$
2. $18/5$
3. $12/3$
4. $8/2$
5. $24/3$
6. $35/2$
7. $42/3$
8. $16/3$
9. $20/4$

1-9	89	78	67	56	44	33	22	11	0