# Improper and Mixed Fractions Visual

Name:

**Write each amount as a mixed number.**

1) 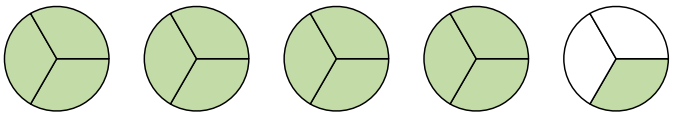

2) 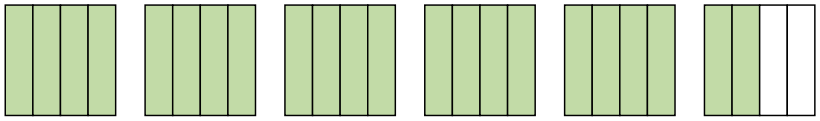

3) 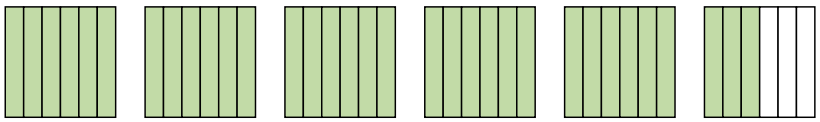

4) 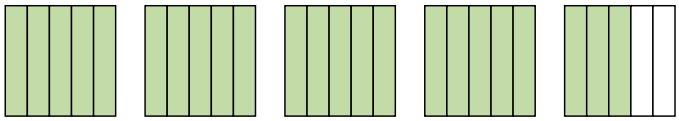

5) 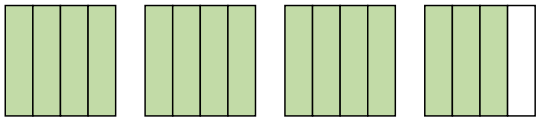

**Write each amount as an improper fraction.**

6) 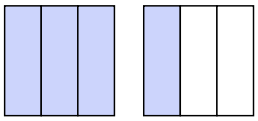

7) 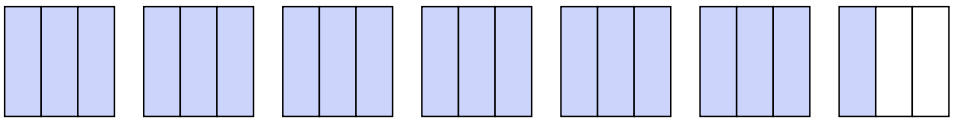

8) 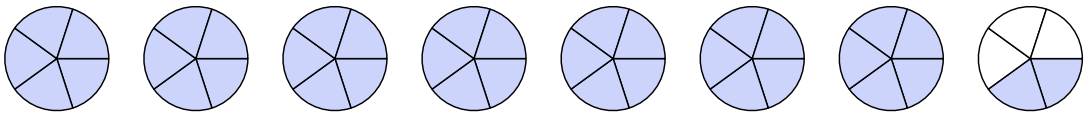

9) 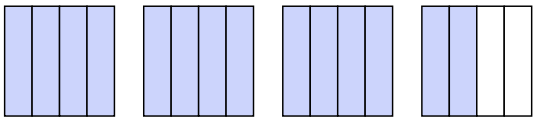

10) 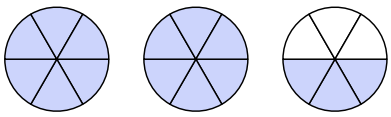

11) 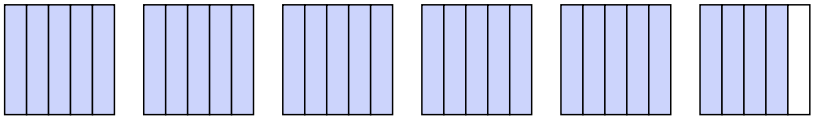

**Answers**

1. _____
2. _____
3. _____
4. _____
5. _____
6. _____
7. _____
8. _____
9. _____
10. _____
11. _____



| | | | | | | | | | | |
|---|---|---|---|---|---|---|---|---|---|---|
| 1-10 | 91 | 82 | 73 | 64 | 55 | 45 | 36 | 27 | 18 | 9 |
| 11 | 0 | | | | | | | | | |

Improper and Mixed Fractions Visual

Name: **Answer Key**

**Write each amount as a mixed number.**

1) 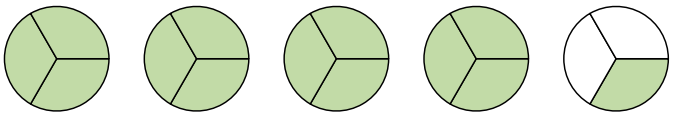

2) 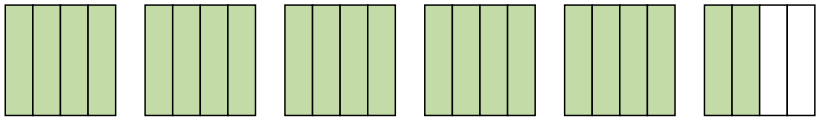

3) 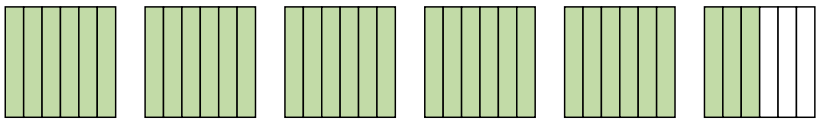

4) 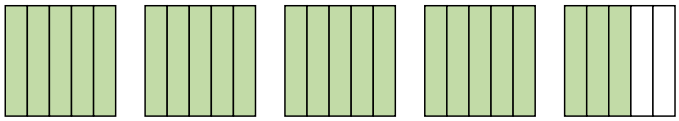

5) 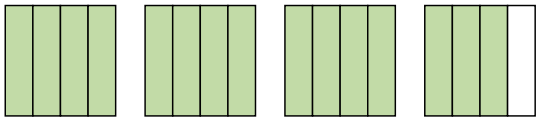

**Write each amount as an improper fraction.**

6) 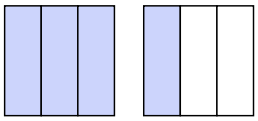

7) 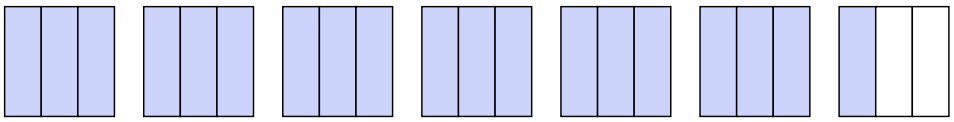

8) 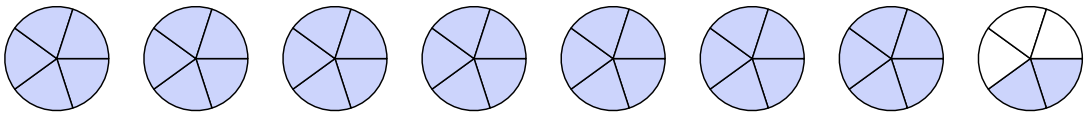

9) 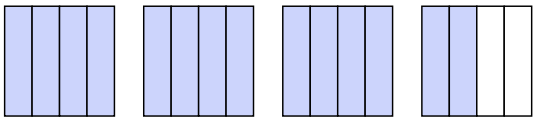

10) 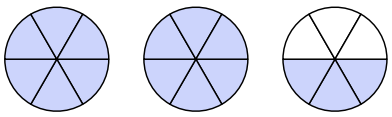

11) 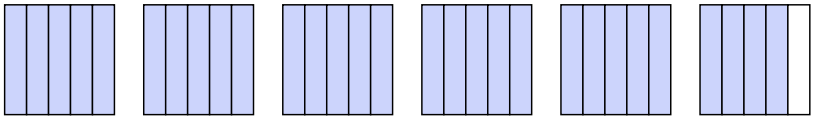

**Answers**

1. $4\frac{1}{3}$
2. $5\frac{2}{4}$
3. $5\frac{3}{6}$
4. $4\frac{3}{5}$
5. $3\frac{3}{4}$
6. $\frac{4}{3}$
7. $\frac{19}{3}$
8. $\frac{37}{5}$
9. $\frac{14}{4}$
10. $\frac{15}{6}$
11. $\frac{29}{5}$



| | | | | | | | | | | |
|---|---|---|---|---|---|---|---|---|---|---|
| 1-10 | 91 | 82 | 73 | 64 | 55 | 45 | 36 | 27 | 18 | 9 |
| 11 | 0 | | | | | | | | | |