Fraction, Decimal & Percent (Visual) Name:

Determine the value written as a fraction , decimal & a percent.

Ex)

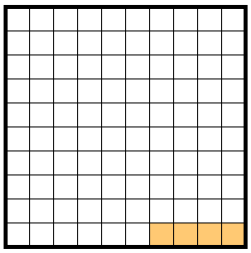

fraction $^{4}/_{100}$
decimal 0.04
percent 4

1)

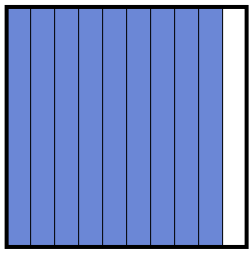

fraction _____
decimal _____
percent _____

2)



fraction _____
decimal _____
percent _____

3)



fraction _____
decimal _____
percent _____

4)

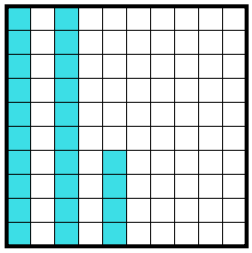

fraction _____
decimal _____
percent _____

5)

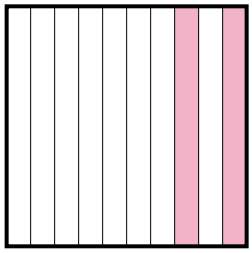

fraction _____
decimal _____
percent _____

6)

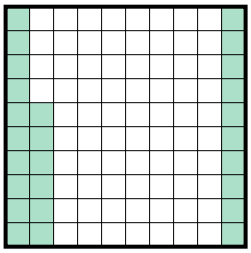

fraction _____
decimal _____
percent _____

7)

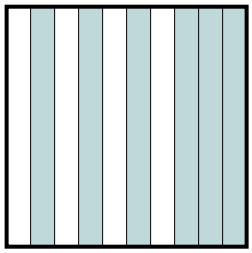

fraction _____
decimal _____
percent _____

8)

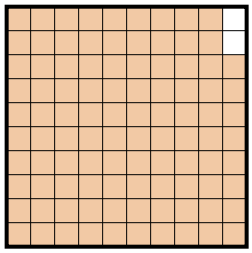

fraction _____
decimal _____
percent _____

9)

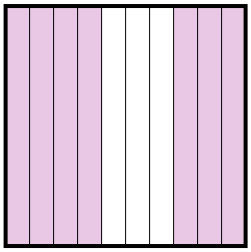

fraction _____
decimal _____
percent _____

10)

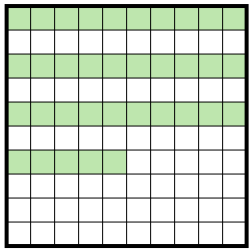

fraction _____
decimal _____
percent _____

11)

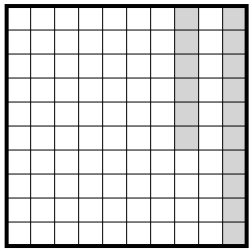

fraction _____
decimal _____
percent _____

Answers

Ex.	$^{4}/_{100}$	0.04	4%
1.			
2.			
3.			
4.			
5.			
6.			
7.			
8.			
9.			
10.			
11.			

1-10	91	82	73	64	55	45	36	27	18	9
11	0									

Fraction, Decimal & Percent (Visual) Name: **Answer Key**

Determine the value written as a fraction , decimal & a percent.

Ex)

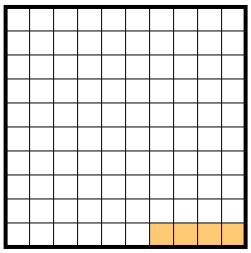

fraction $4/100$
decimal 0.04
percent 4

1)

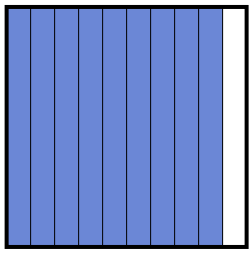

fraction $9/10$
decimal 0.9
percent 90

2)



fraction $8/10$
decimal 0.8
percent 80

3)



fraction $3/10$
decimal 0.3
percent 30

4)

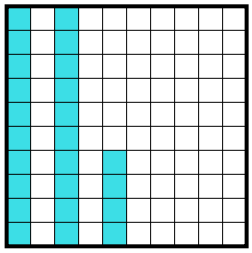

fraction $24/100$
decimal 0.24
percent 24

5)

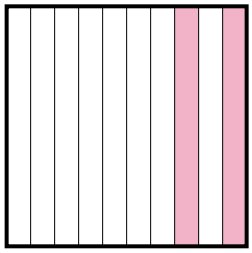

fraction $2/10$
decimal 0.2
percent 20

6)

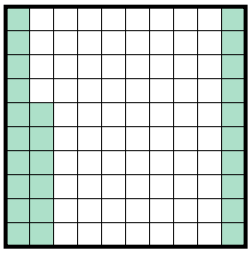

fraction $26/100$
decimal 0.26
percent 26

7)

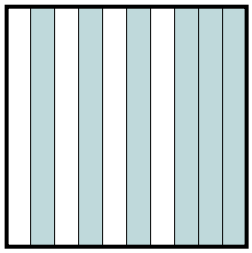

fraction $6/10$
decimal 0.6
percent 60

8)

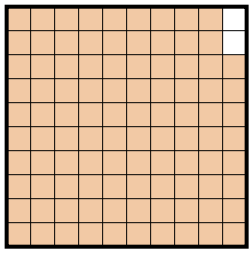

fraction $98/100$
decimal 0.98
percent 98

9)

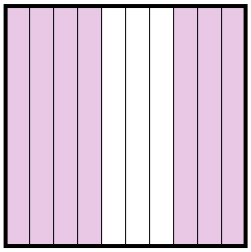

fraction $7/10$
decimal 0.7
percent 70

10)

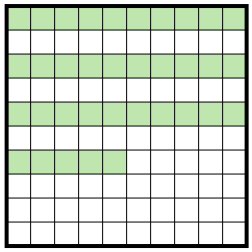

fraction $35/100$
decimal 0.35
percent 35

11)

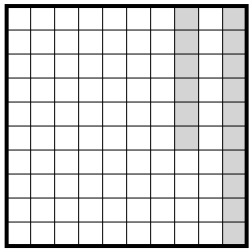

fraction $16/100$
decimal 0.16
percent 16

Answers

Ex.	$4/100$	0.04	4%
1.	$9/10$	0.9	90%
2.	$8/10$	0.8	80%
3.	$3/10$	0.3	30%
4.	$24/100$	0.24	24%
5.	$2/10$	0.2	20%
6.	$26/100$	0.26	26%
7.	$6/10$	0.6	60%
8.	$98/100$	0.98	98%
9.	$7/10$	0.7	70%
10.	$35/100$	0.35	35%
11.	$16/100$	0.16	16%

1-10	91	82	73	64	55	45	36	27	18	9
11	0									