Matching Addition

Name:

Express the visual problem as an equation with answer.

1) 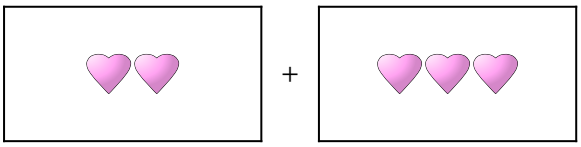

2) 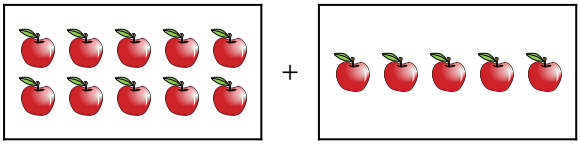

3) 

4) 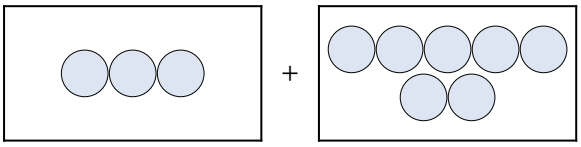

5) 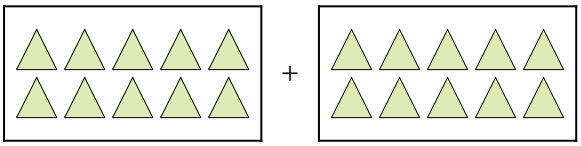

6) 

7) 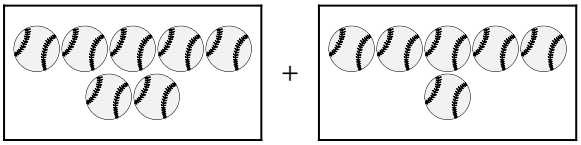

8) 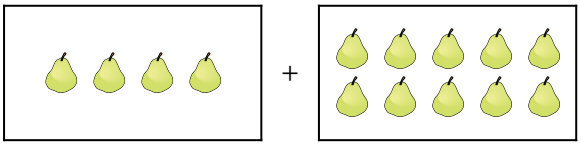

9) 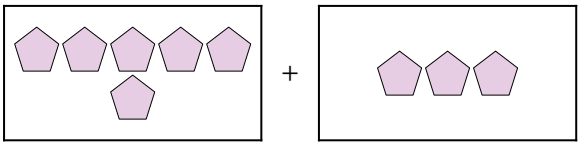

10) 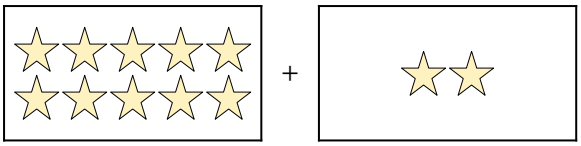

Answers

1. _____
2. _____
3. _____
4. _____
5. _____
6. _____
7. _____
8. _____
9. _____
10. _____

1-10	90	80	70	60	50	40	30	20	10	0

Matching Addition

Name: **Answer Key**

Express the visual problem as an equation with answer.

1)

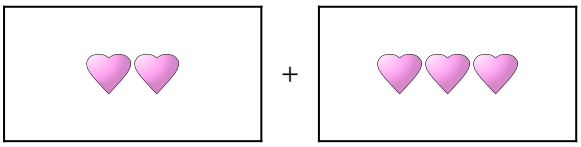

2)

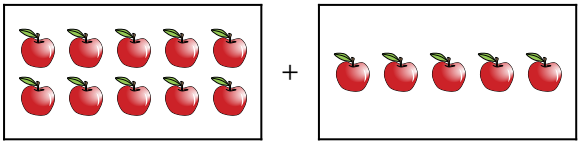

3)



4)

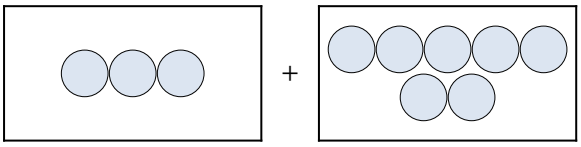

5)

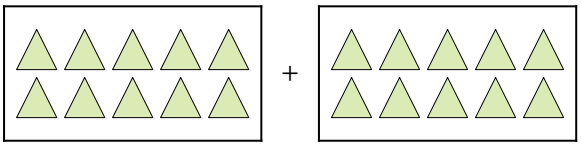

6)



7)

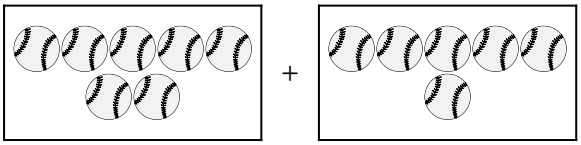

8)

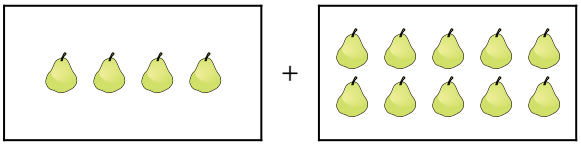

9)

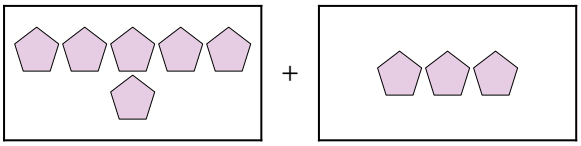

10)

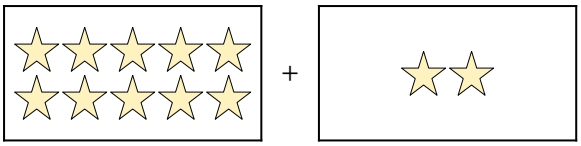

Answers

1. 2 + 3 = 5
2. 10 + 5 = 15
3. 3 + 6 = 9
4. 3 + 7 = 10
5. 10 + 10 = 20
6. 10 + 3 = 13
7. 7 + 6 = 13
8. 4 + 10 = 14
9. 6 + 3 = 9
10. 10 + 2 = 12

1-10	90	80	70	60	50	40	30	20	10	0