Dividing with a Numberline

Name:

Use the numberline to solve each problem.

1) 15÷5=

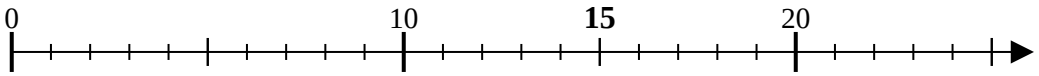

2) 6÷3=

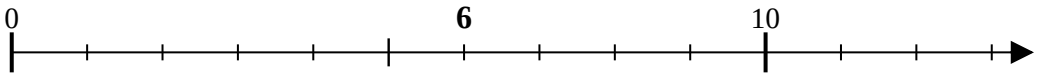

3) 12÷4=

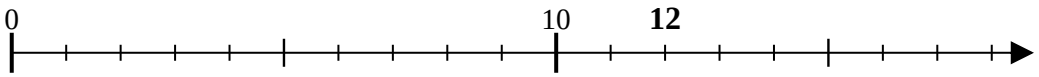

4) 25÷5=

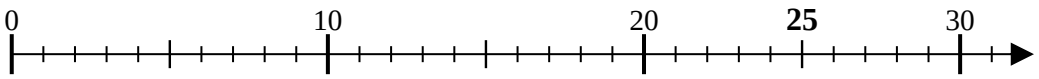

5) 16÷4=

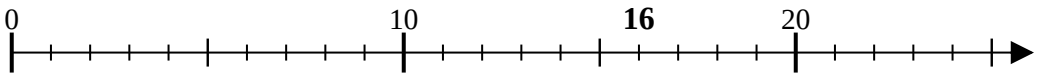

6) 10÷2=

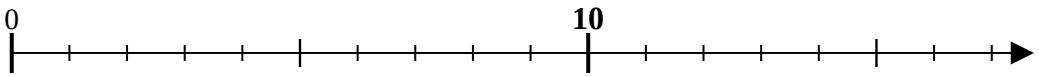

7) 8÷2=

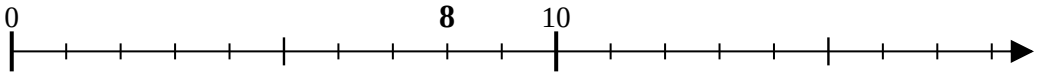

8) 16÷8=

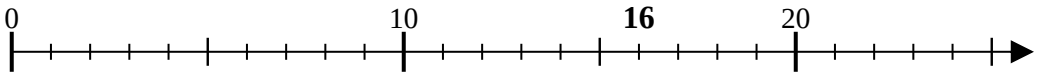

9) 24÷6=

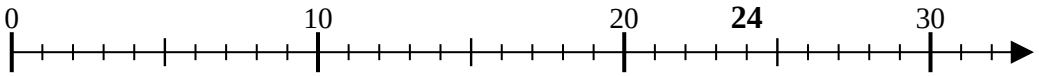

10) 45÷9=

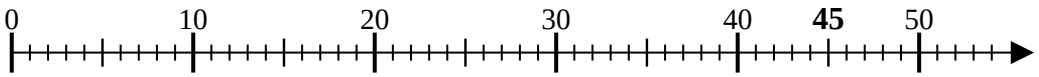

11) 8÷4=

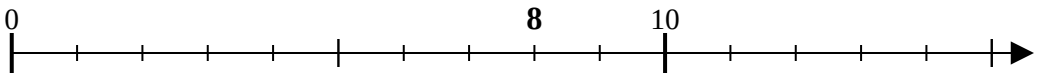

Answers

1. _____
2. _____
3. _____
4. _____
5. _____
6. _____
7. _____
8. _____
9. _____
10. _____
11. _____

Dividing with a Numberline

Name: **Answer Key**

Use the numberline to solve each problem.

1) 15÷5=

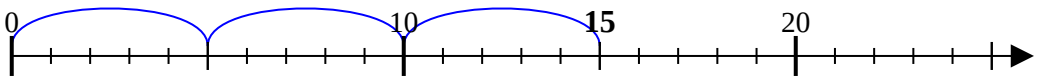

2) 6÷3=

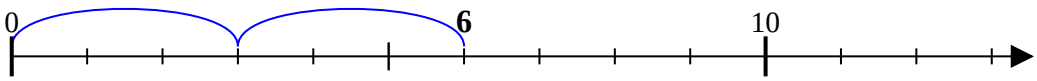

3) 12÷4=

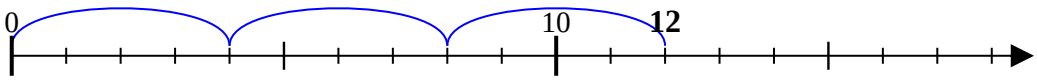

4) 25÷5=

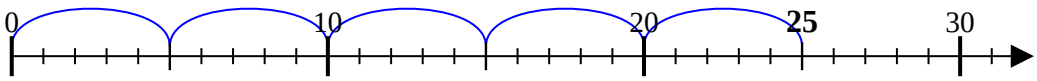

5) 16÷4=

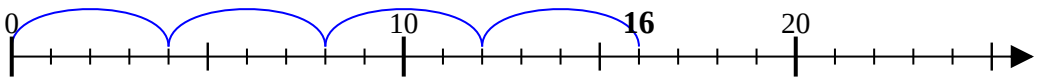

6) 10÷2=

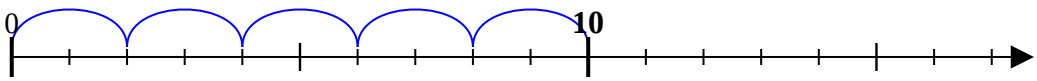

7) 8÷2=

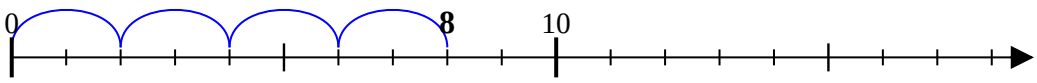

8) 16÷8=

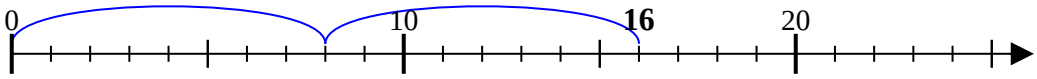

9) 24÷6=

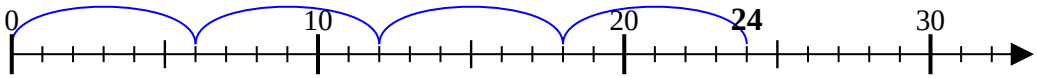

10) 45÷9=

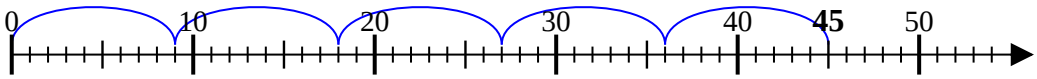

11) 8÷4=

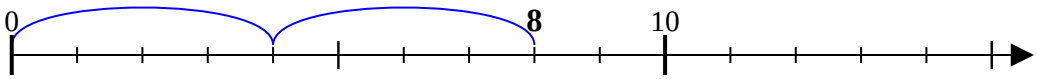

Answers

1. 3
2. 2
3. 3
4. 5
5. 4
6. 5
7. 4
8. 2
9. 4
10. 5
11. 2

1-10	91	82	73	64	55	45	36	27	18	9
11	0									