Determining Decimal Value (Visual)

Name:

Determine the amount shaded of the whole. Write your answer as a decimal.

1)

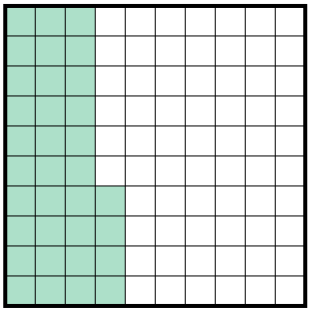

2)

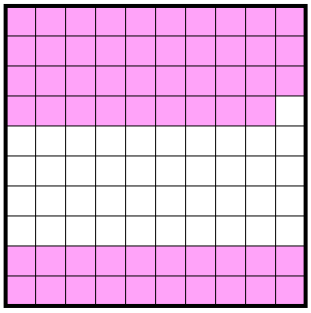

3)



4)

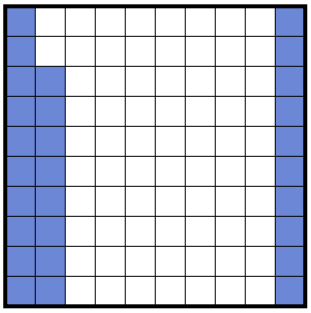

5)

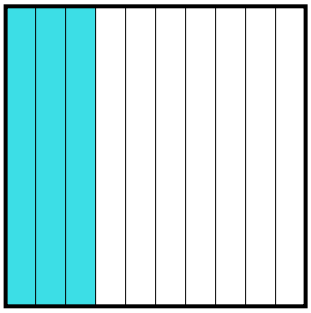

6)

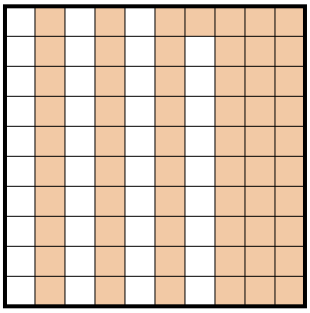

7)

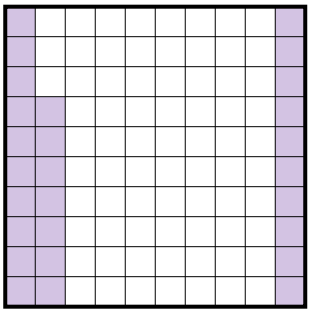

8)



9)

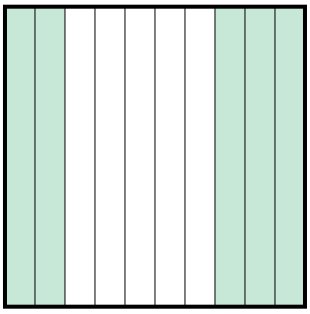

10)

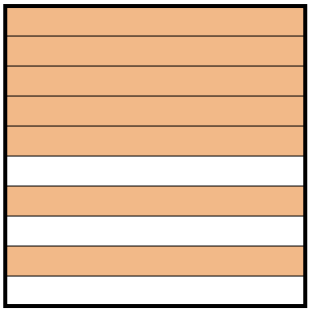

11)

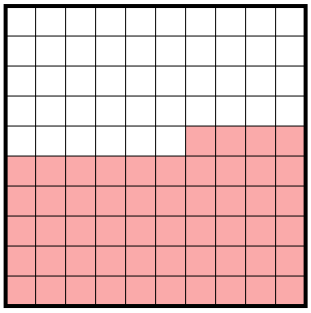

12)

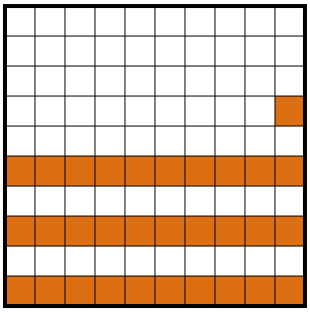

Answers

1. _____
2. _____
3. _____
4. _____
5. _____
6. _____
7. _____
8. _____
9. _____
10. _____
11. _____
12. _____

1-10	92	83	75	67	58	50	42	33	25	17
11-12	8	0								

Determining Decimal Value (Visual) Name: **Answer Key**

Determine the amount shaded of the whole. Write your answer as a decimal.

1) 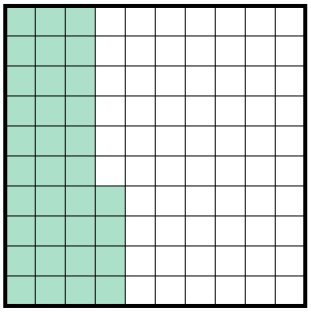

2) 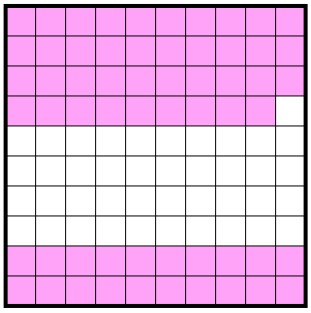

3) 

4) 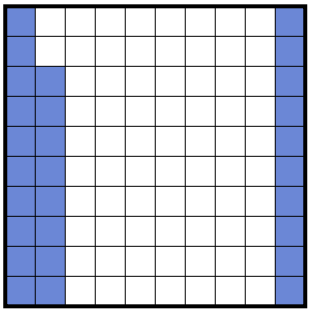

5) 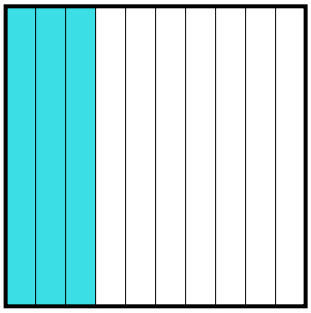

6) 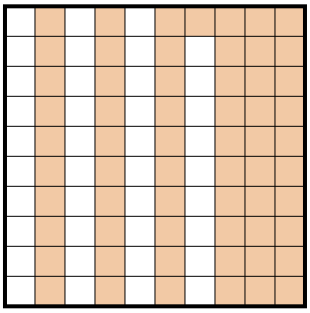

7) 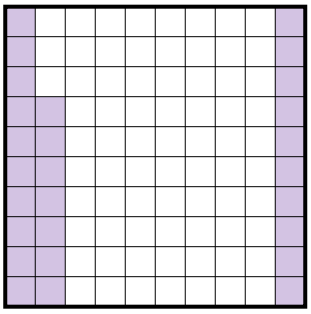

8) 

9) 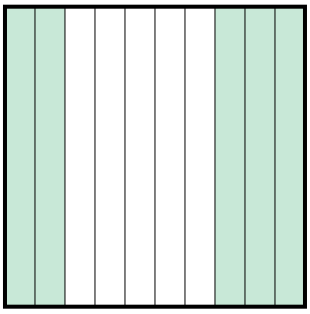

10) 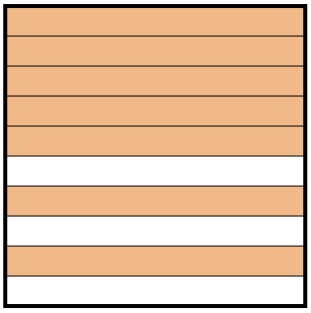

11) 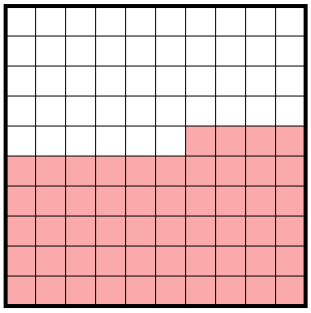

12) 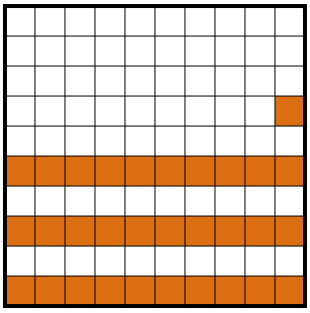

Answers

1. 0.34
2. 0.59
3. 0.2
4. 0.28
5. 0.3
6. 0.61
7. 0.27
8. 0.1
9. 0.5
10. 0.7
11. 0.54
12. 0.31

1-10	92	83	75	67	58	50	42	33	25	17
11-12	8	0								