Finding the Circumference of a Circle

Name:

Find the circumference (in cm) of the circle. Circles are not to scale.

1)

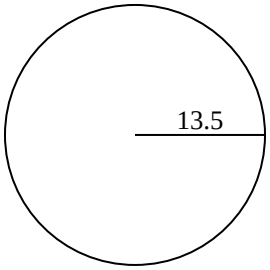

2)

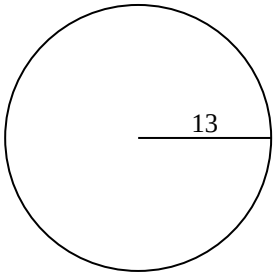

3)

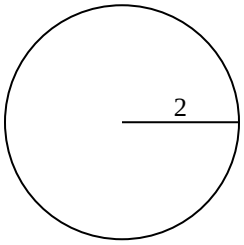

4)

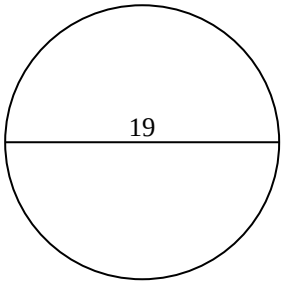

5)

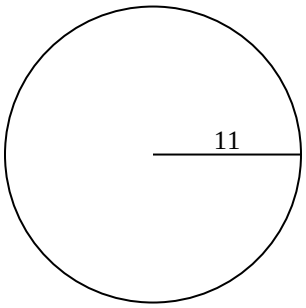

6)

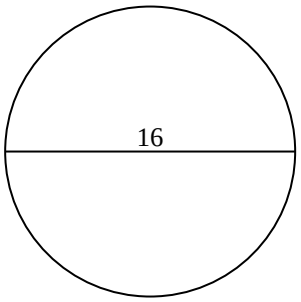

7)

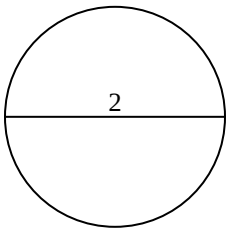

8)

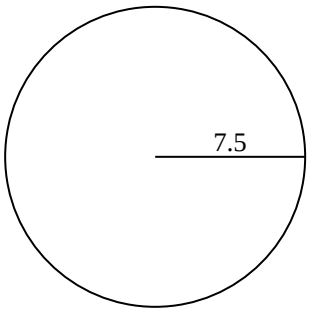

9)

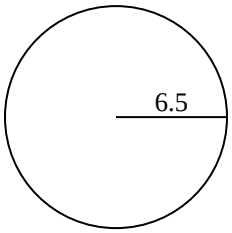

10)

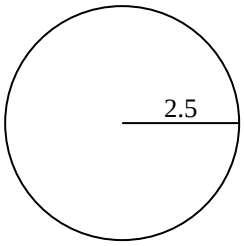

Answers

1. _____
2. _____
3. _____
4. _____
5. _____
6. _____
7. _____
8. _____
9. _____
10. _____

1-10	90	80	70	60	50	40	30	20	10	0

Finding the Circumference of a Circle

Name: **Answer Key**

Find the circumference (in cm) of the circle. Circles are not to scale.

1)

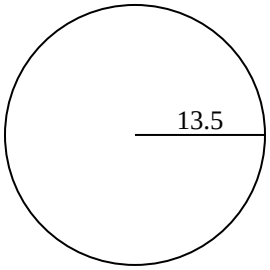

2)

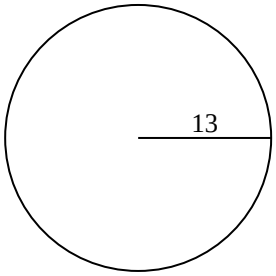

3)

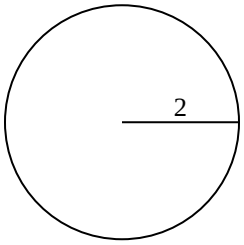

4)

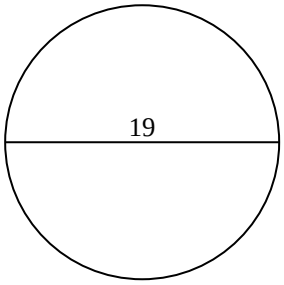

5)

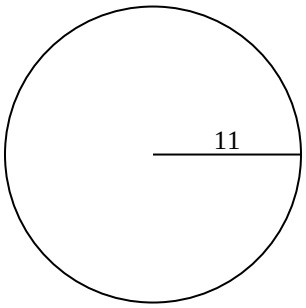

6)

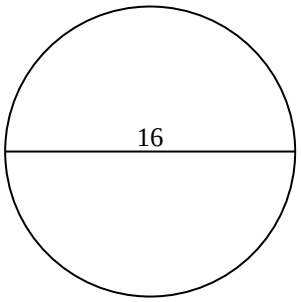

7)

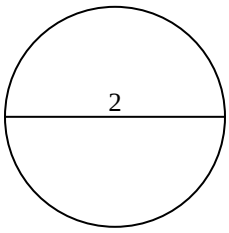

8)

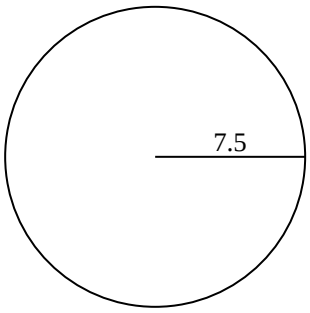

9)

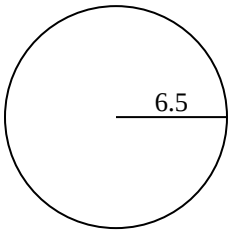

10)

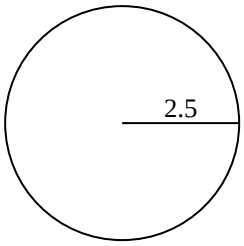

Answers

1. **84.82 cm**
2. **81.68 cm**
3. **12.57 cm**
4. **59.69 cm**
5. **69.12 cm**
6. **50.27 cm**
7. **6.28 cm**
8. **47.12 cm**
9. **40.84 cm**
10. **15.71 cm**

1-10	90	80	70	60	50	40	30	20	10	0

Finding the Circumference of a Circle

Name:

Find the circumference (in cm) of the circle. Circles are not to scale.

69.12 cm	6.28 cm	81.68 cm	15.71 cm	12.57 cm
50.27 cm	47.12 cm	84.82 cm	59.69 cm	40.84 cm

1)

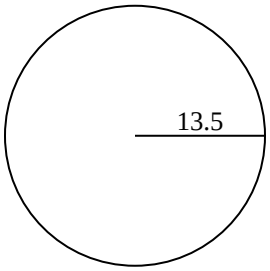

2)

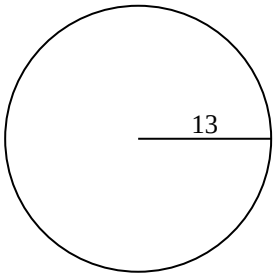

3)

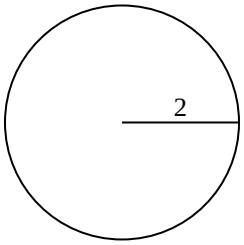

4)

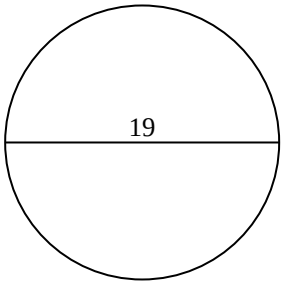

5)

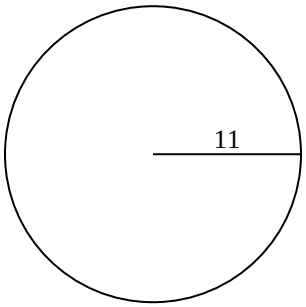

6)

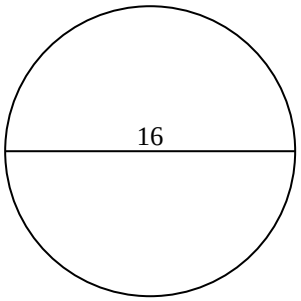

7)

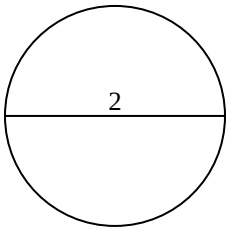

8)

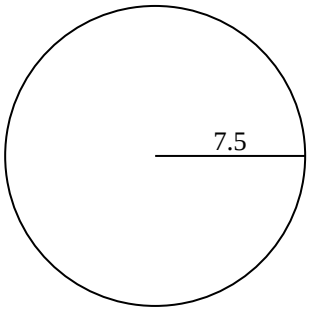

9)

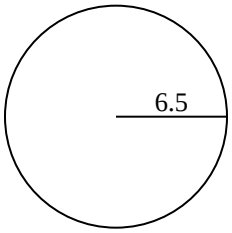

10)

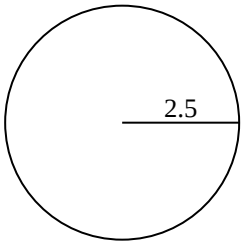

Answers

1. _____
2. _____
3. _____
4. _____
5. _____
6. _____
7. _____
8. _____
9. _____
10. _____

1-10	90	80	70	60	50	40	30	20	10	0

Finding the Circumference of a Circle

Name:

Find the circumference (in cm) of the circle. Circles are not to scale.

1)

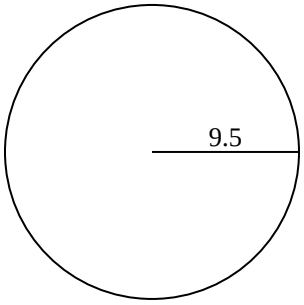

2)

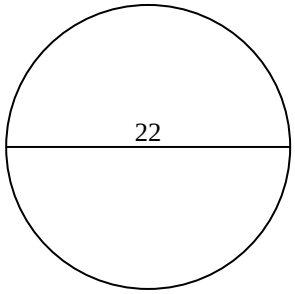

3)

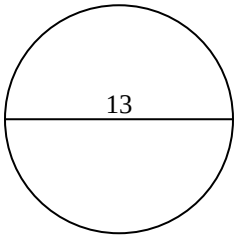

4)

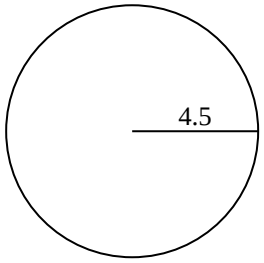

5)

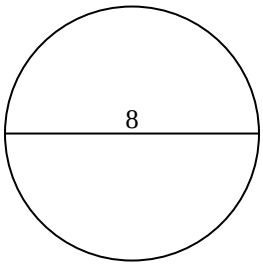

6)

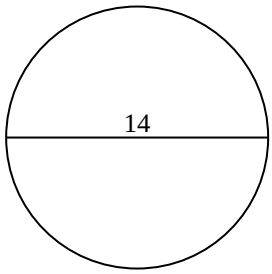

7)

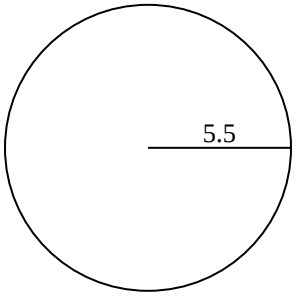

8)

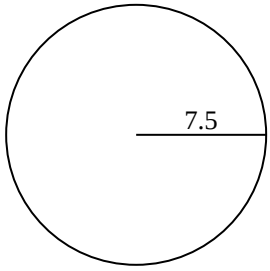

9)

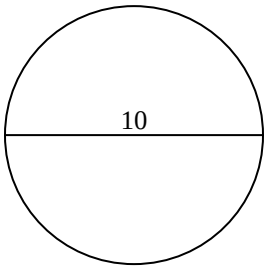

10)

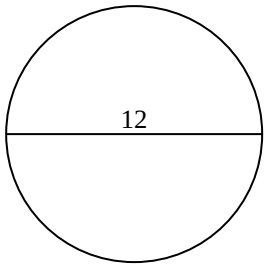

Answers

1. _____
2. _____
3. _____
4. _____
5. _____
6. _____
7. _____
8. _____
9. _____
10. _____

1-10	90	80	70	60	50	40	30	20	10	0

Finding the Circumference of a Circle

Name: **Answer Key**

Find the circumference (in cm) of the circle. Circles are not to scale.

1)

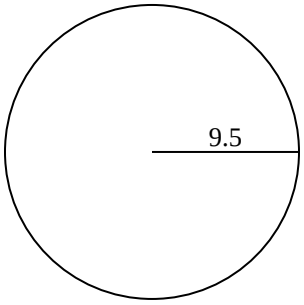

2)

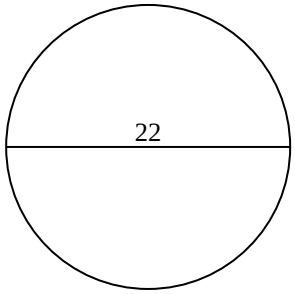

3)

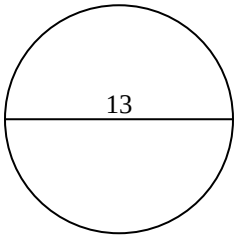

4)

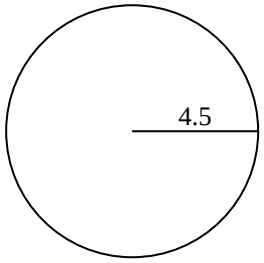

5)

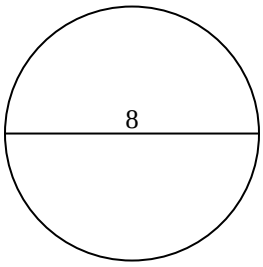

6)

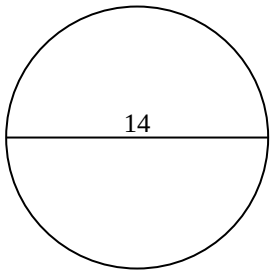

7)

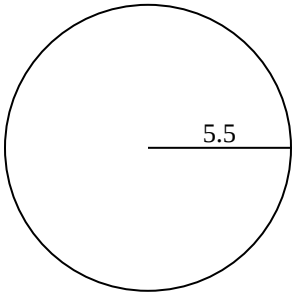

8)

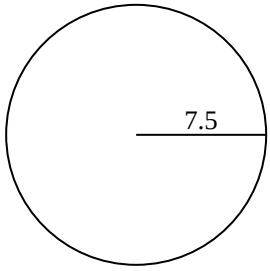

9)

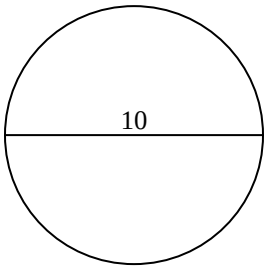

10)

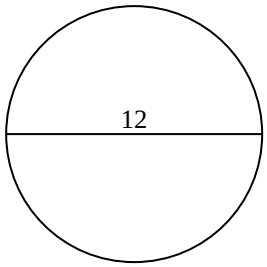

Answers

1. **59.69 cm**
2. **69.12 cm**
3. **40.84 cm**
4. **28.27 cm**
5. **25.13 cm**
6. **43.98 cm**
7. **34.56 cm**
8. **47.12 cm**
9. **31.42 cm**
10. **37.7 cm**

1-10	90	80	70	60	50	40	30	20	10	0

Finding the Circumference of a Circle Name:

Find the circumference (in cm) of the circle. Circles are not to scale.

59.69 cm	25.13 cm	31.42 cm	40.84 cm	34.56 cm
28.27 cm	37.7 cm	69.12 cm	47.12 cm	43.98 cm

1)

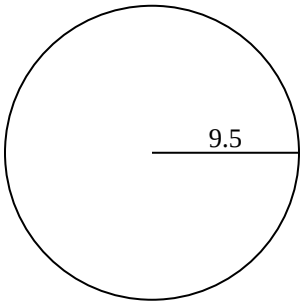

2)

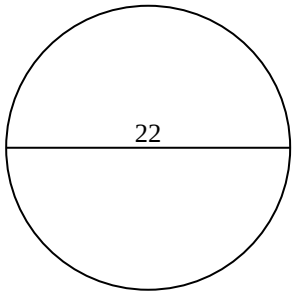

3)

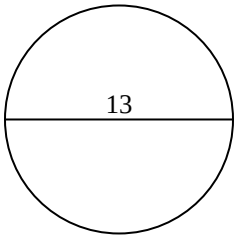

4)

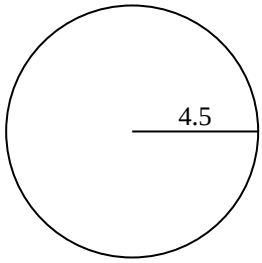

5)

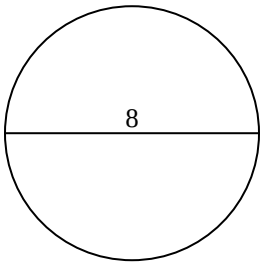

6)

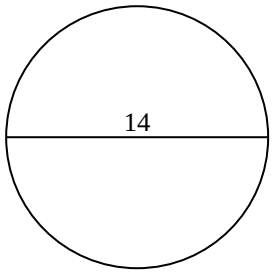

7)

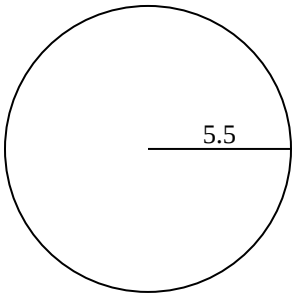

8)

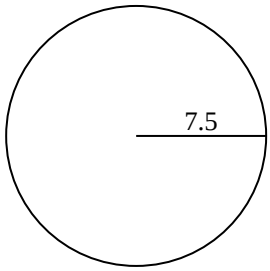

9)

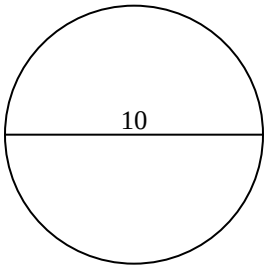

10)

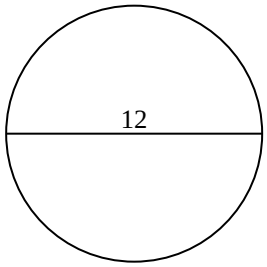

Answers

1. _____
2. _____
3. _____
4. _____
5. _____
6. _____
7. _____
8. _____
9. _____
10. _____

1-10	90	80	70	60	50	40	30	20	10	0

Finding the Circumference of a Circle

Name:

Find the circumference (in cm) of the circle. Circles are not to scale.

1)

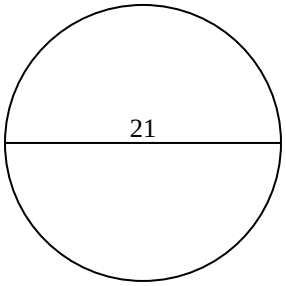

2)

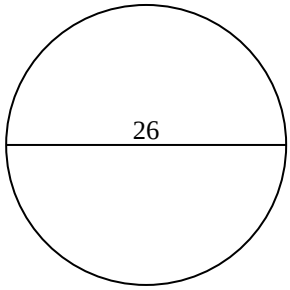

3)

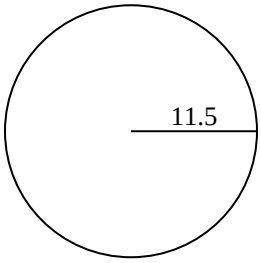

4)

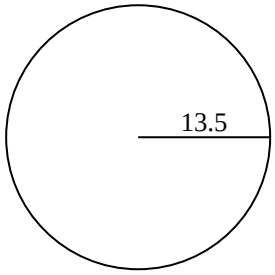

5)

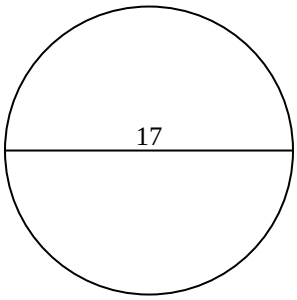

6)

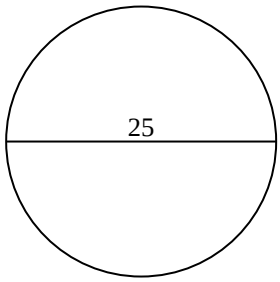

7)

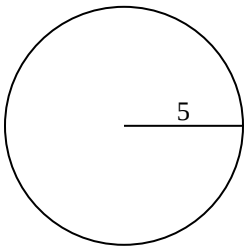

8)

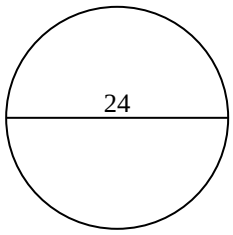

9)

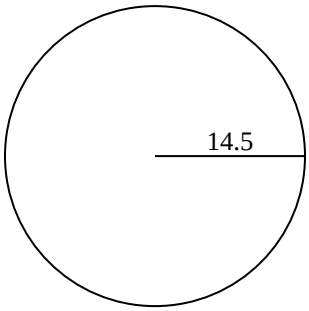

10)

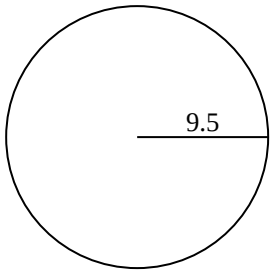

Answers

1. _____
2. _____
3. _____
4. _____
5. _____
6. _____
7. _____
8. _____
9. _____
10. _____

1-10	90	80	70	60	50	40	30	20	10	0

Finding the Circumference of a Circle Name: **Answer Key**

Find the circumference (in cm) of the circle. Circles are not to scale.

1)

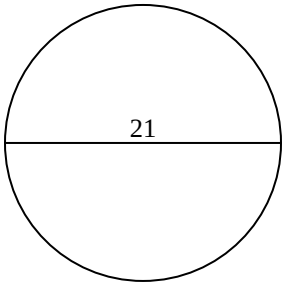

2)

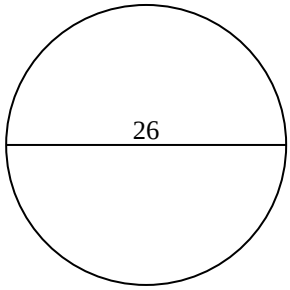

3)

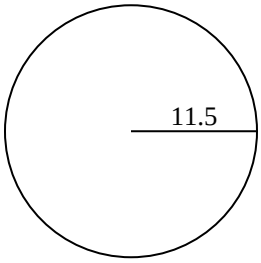

4)

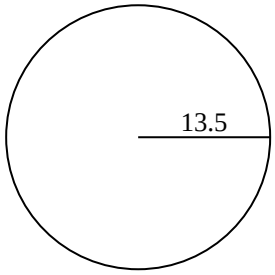

5)

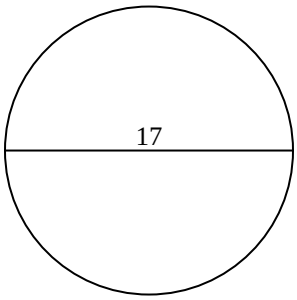

6)

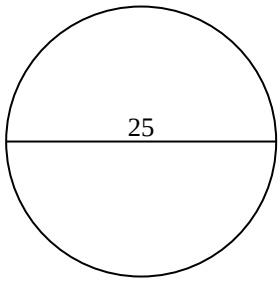

7)

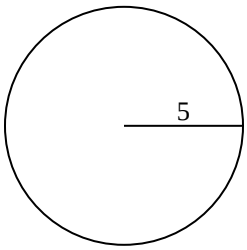

8)

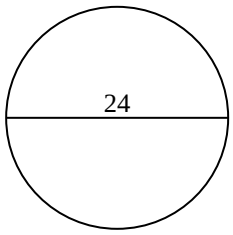

9)

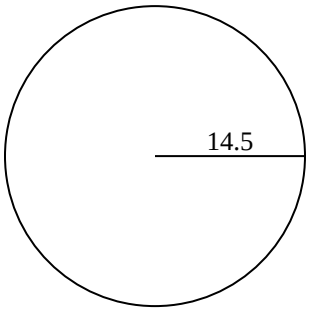

10)

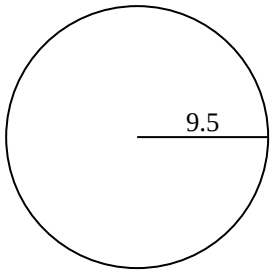

Answers

1. **65.97 cm**
2. **81.68 cm**
3. **72.26 cm**
4. **84.82 cm**
5. **53.41 cm**
6. **78.54 cm**
7. **31.42 cm**
8. **75.4 cm**
9. **91.11 cm**
10. **59.69 cm**

1-10	90	80	70	60	50	40	30	20	10	0

Finding the Circumference of a Circle Name:

Find the circumference (in cm) of the circle. Circles are not to scale.

84.82 cm	78.54 cm	53.41 cm	65.97 cm	91.11 cm
72.26 cm	31.42 cm	75.4 cm	59.69 cm	81.68 cm

1)

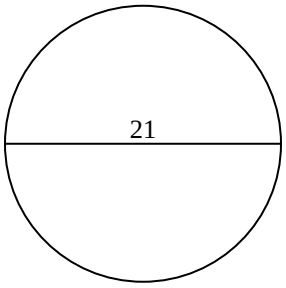

2)

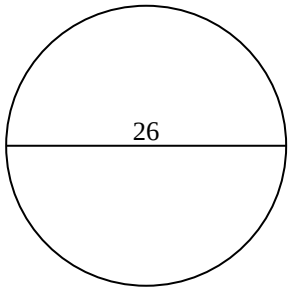

3)

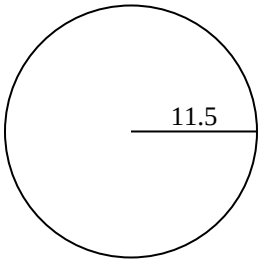

4)

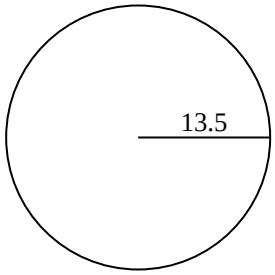

5)

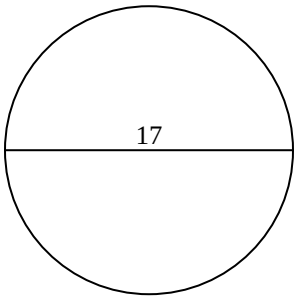

6)

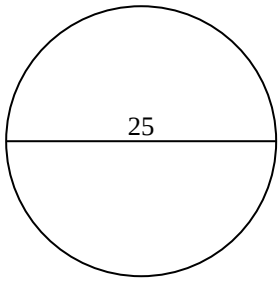

7)

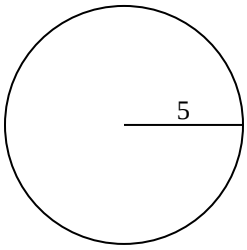

8)

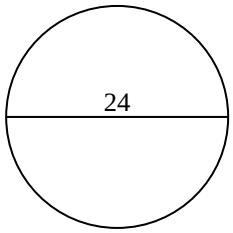

9)

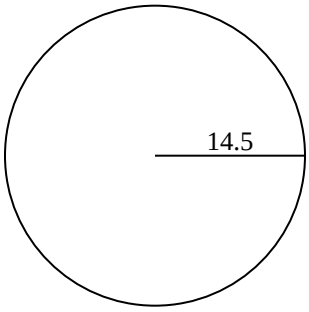

10)

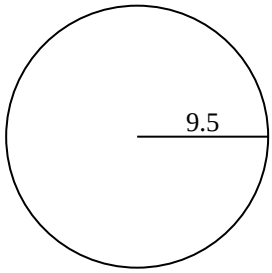

Answers

1. _____
2. _____
3. _____
4. _____
5. _____
6. _____
7. _____
8. _____
9. _____
10. _____

1-10	90	80	70	60	50	40	30	20	10	0

Finding the Circumference of a Circle

Name:

Find the circumference (in cm) of the circle. Circles are not to scale.

1)

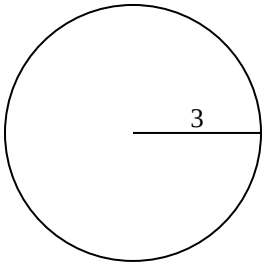

2)

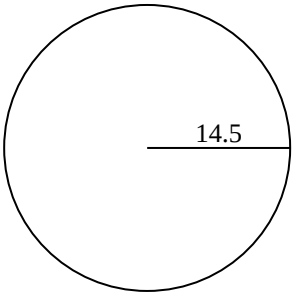

3)

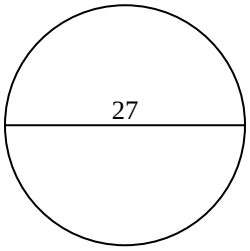

4)

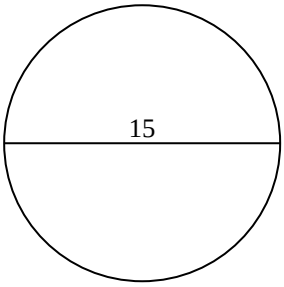

5)

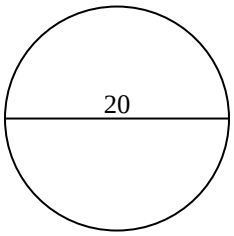

6)

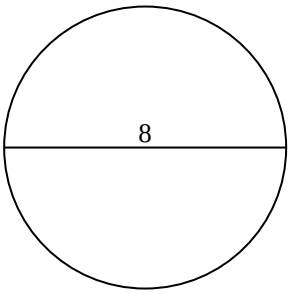

7)

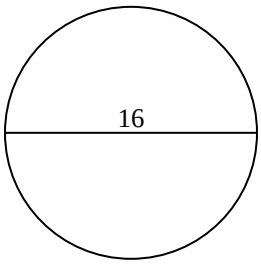

8)

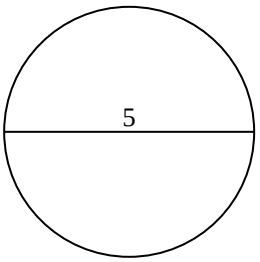

9)

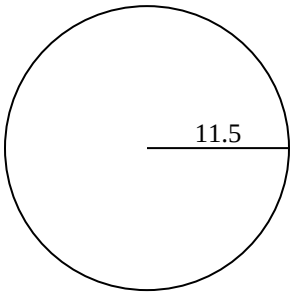

10)

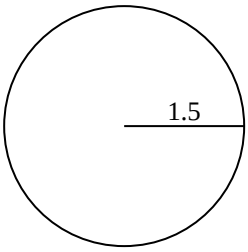

Answers

1. _____
2. _____
3. _____
4. _____
5. _____
6. _____
7. _____
8. _____
9. _____
10. _____

1-10	90	80	70	60	50	40	30	20	10	0

Finding the Circumference of a Circle Name: **Answer Key**

Find the circumference (in cm) of the circle. Circles are not to scale.

1)

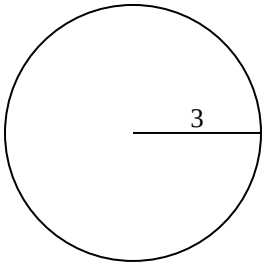

2)

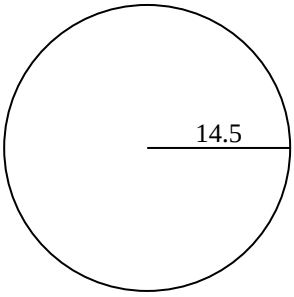

3)

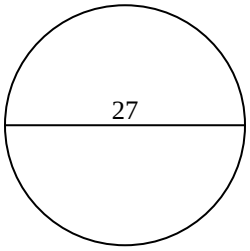

4)

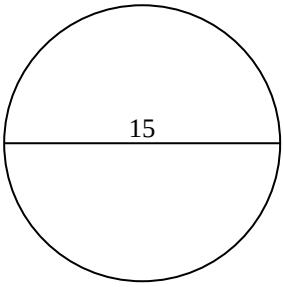

5)

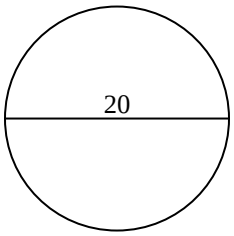

6)

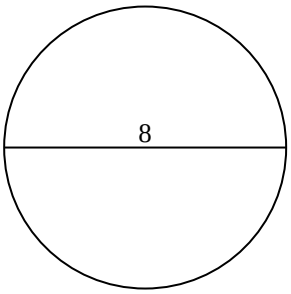

7)

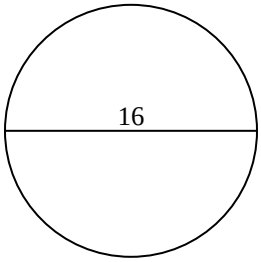

8)

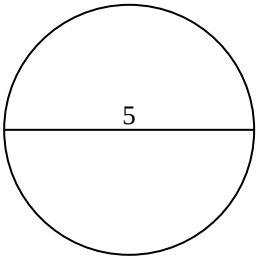

9)

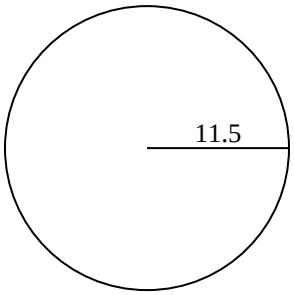

10)

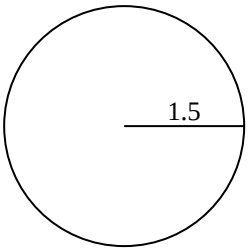

Answers

1. **18.85 cm**
2. **91.11 cm**
3. **84.82 cm**
4. **47.12 cm**
5. **62.83 cm**
6. **25.13 cm**
7. **50.27 cm**
8. **15.71 cm**
9. **72.26 cm**
10. **9.42 cm**

1-10	90	80	70	60	50	40	30	20	10	0

Finding the Circumference of a Circle Name:

Find the circumference (in cm) of the circle. Circles are not to scale.

72.26 cm	9.42 cm	18.85 cm	62.83 cm	50.27 cm
91.11 cm	47.12 cm	84.82 cm	15.71 cm	25.13 cm

1)

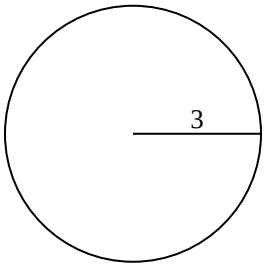

2)

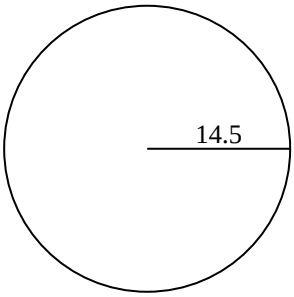

3)

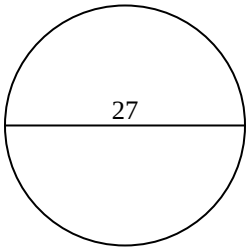

4)

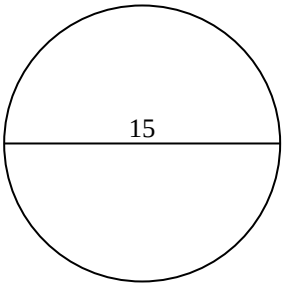

5)

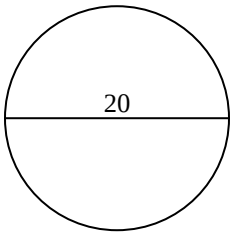

6)

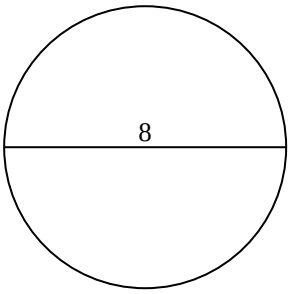

7)

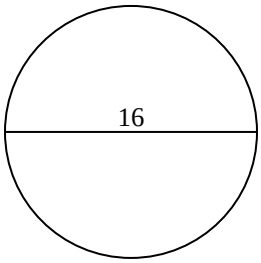

8)

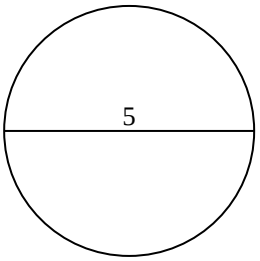

9)

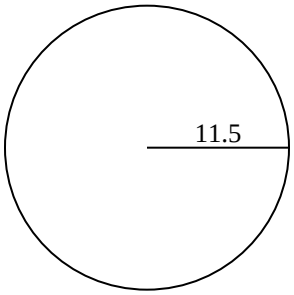

10)

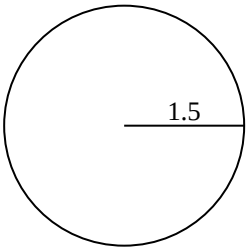

Answers

1. _____
2. _____
3. _____
4. _____
5. _____
6. _____
7. _____
8. _____
9. _____
10. _____

1-10	90	80	70	60	50	40	30	20	10	0

Finding the Circumference of a Circle

Name:

Find the circumference (in cm) of the circle. Circles are not to scale.

1)

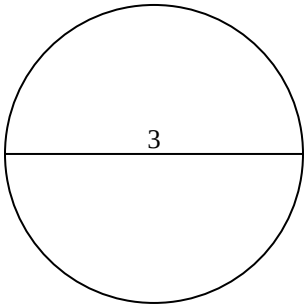

2)

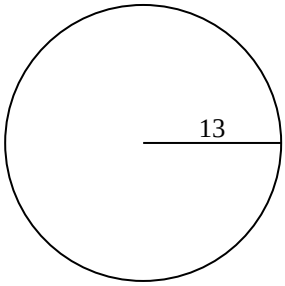

3)

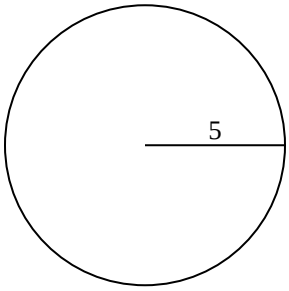

4)

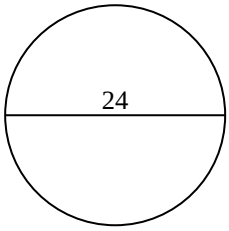

5)

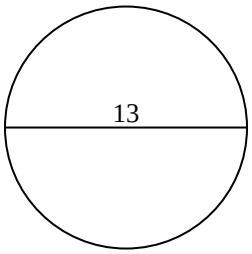

6)

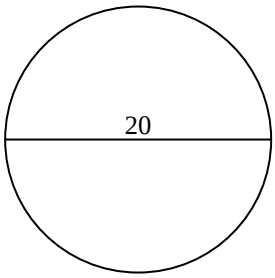

7)

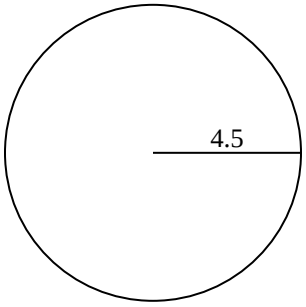

8)

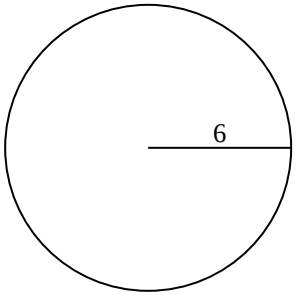

9)

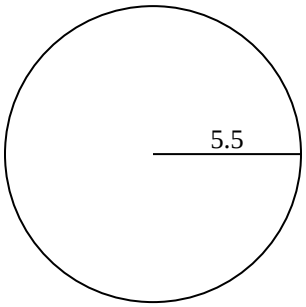

10)

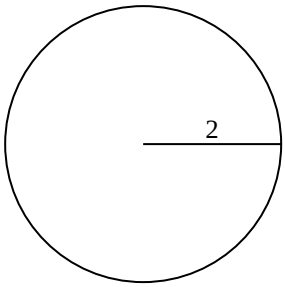

Answers

1. _____
2. _____
3. _____
4. _____
5. _____
6. _____
7. _____
8. _____
9. _____
10. _____

1-10	90	80	70	60	50	40	30	20	10	0

Finding the Circumference of a Circle Name: **Answer Key**

Find the circumference (in cm) of the circle. Circles are not to scale.

1)

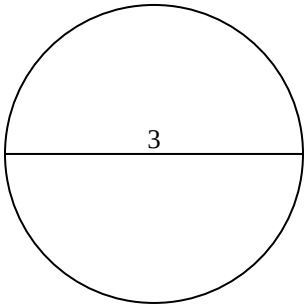

2)

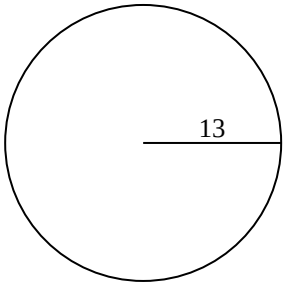

3)

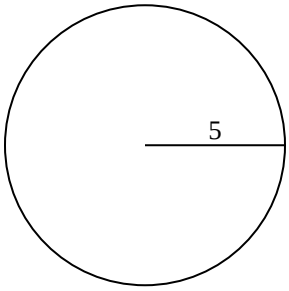

4)

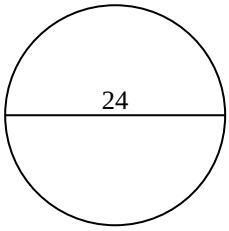

5)

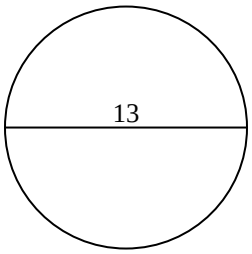

6)

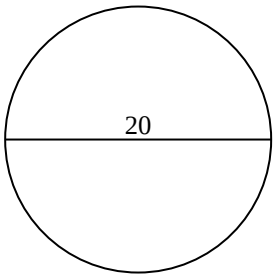

7)

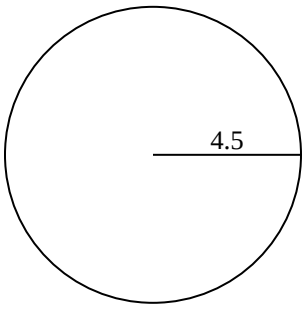

8)

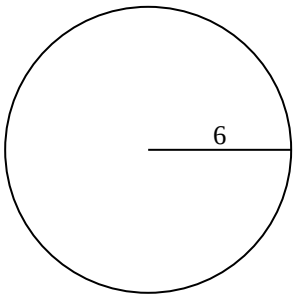

9)

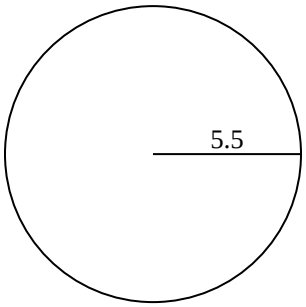

10)

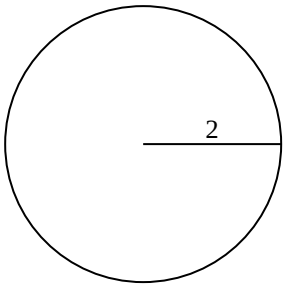

Answers

1. **9.42 cm**
2. **81.68 cm**
3. **31.42 cm**
4. **75.4 cm**
5. **40.84 cm**
6. **62.83 cm**
7. **28.27 cm**
8. **37.7 cm**
9. **34.56 cm**
10. **12.57 cm**

1-10	90	80	70	60	50	40	30	20	10	0

Finding the Circumference of a Circle

Name:

Find the circumference (in cm) of the circle. Circles are not to scale.

12.57 cm	28.27 cm	62.83 cm	34.56 cm	81.68 cm
9.42 cm	37.7 cm	75.4 cm	31.42 cm	40.84 cm

1)

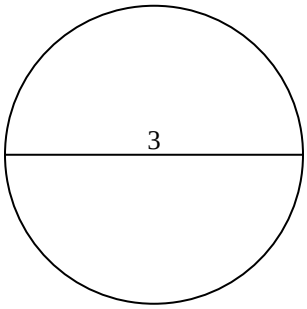

2)

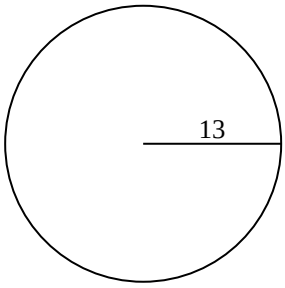

3)

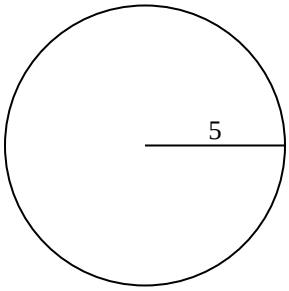

4)

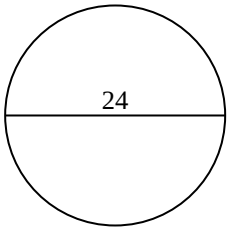

5)

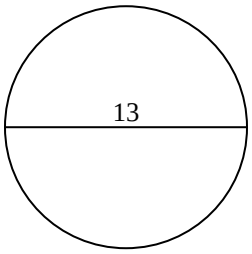

6)

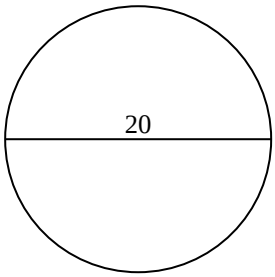

7)

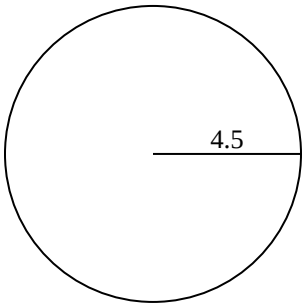

8)

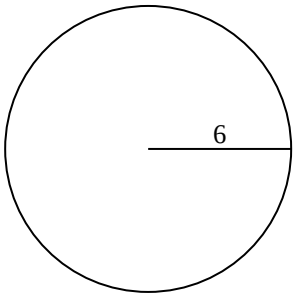

9)

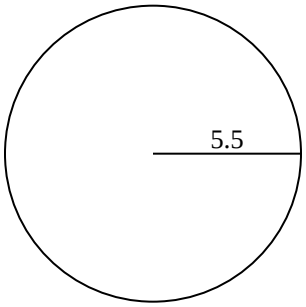

10)

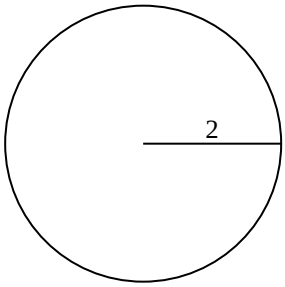

Answers

1. _____
2. _____
3. _____
4. _____
5. _____
6. _____
7. _____
8. _____
9. _____
10. _____

1-10	90	80	70	60	50	40	30	20	10	0

Finding the Circumference of a Circle

Name:

Find the circumference (in cm) of the circle. Circles are not to scale.

1)

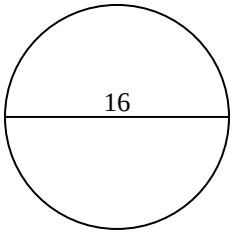

2)

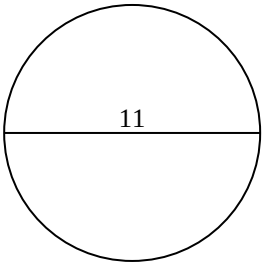

3)

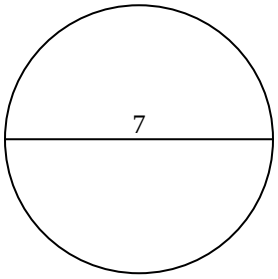

4)

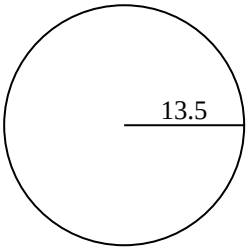

5)

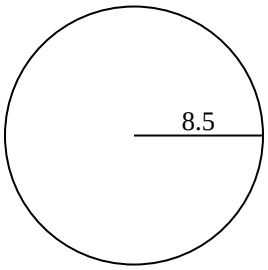

6)

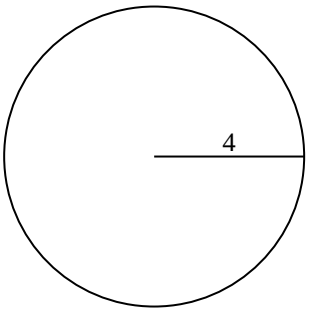

7)

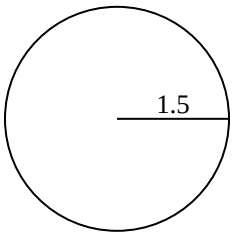

8)

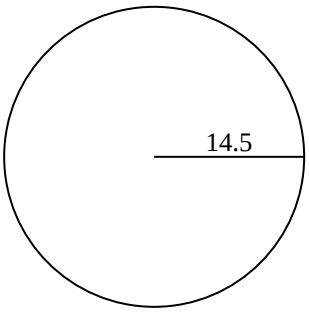

9)

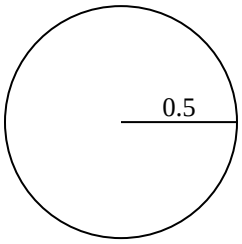

10)

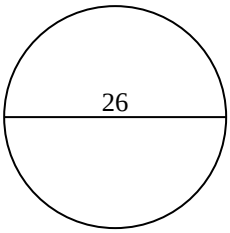

Answers

1. _____
2. _____
3. _____
4. _____
5. _____
6. _____
7. _____
8. _____
9. _____
10. _____

1-10	90	80	70	60	50	40	30	20	10	0

Finding the Circumference of a Circle

Name: **Answer Key**

Find the circumference (in cm) of the circle. Circles are not to scale.

1)

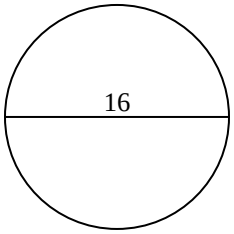

2)

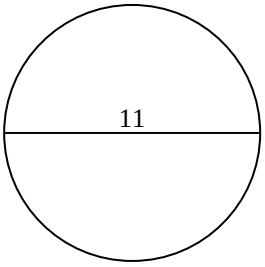

3)

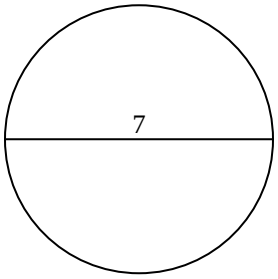

4)

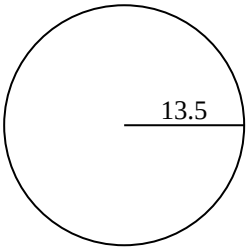

5)

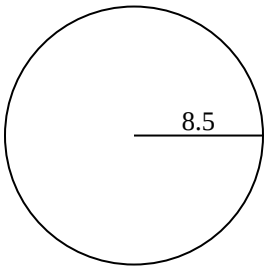

6)

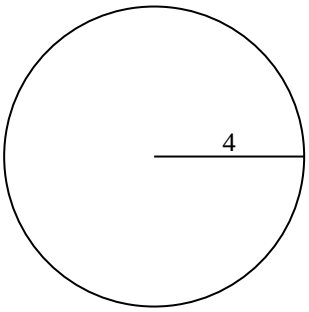

7)

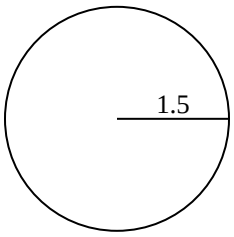

8)

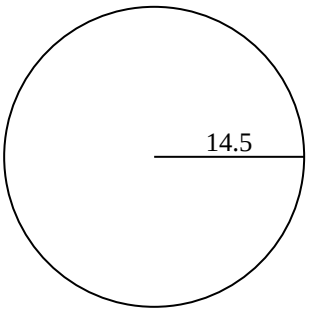

9)

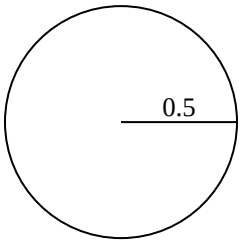

10)

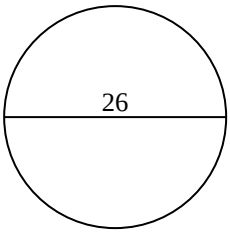

Answers

1. **50.27 cm**
2. **34.56 cm**
3. **21.99 cm**
4. **84.82 cm**
5. **53.41 cm**
6. **25.13 cm**
7. **9.42 cm**
8. **91.11 cm**
9. **3.14 cm**
10. **81.68 cm**

1-10	90	80	70	60	50	40	30	20	10	0

Finding the Circumference of a Circle Name:

Find the circumference (in cm) of the circle. Circles are not to scale.

25.13 cm	81.68 cm	53.41 cm	91.11 cm	50.27 cm
34.56 cm	9.42 cm	21.99 cm	3.14 cm	84.82 cm

1)

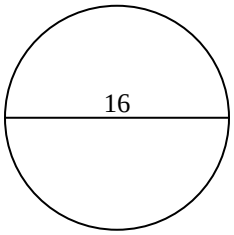

2)

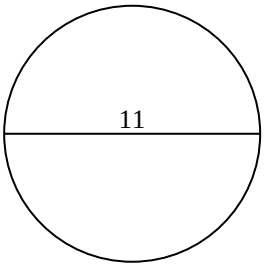

3)

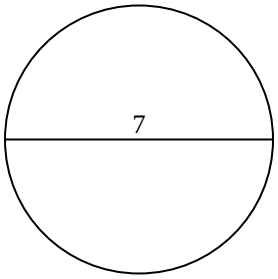

4)

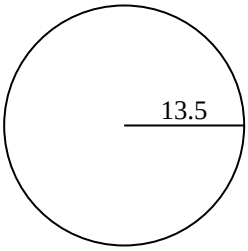

5)

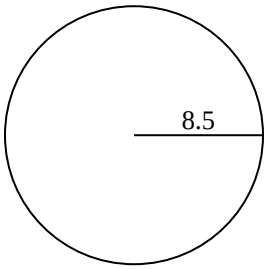

6)

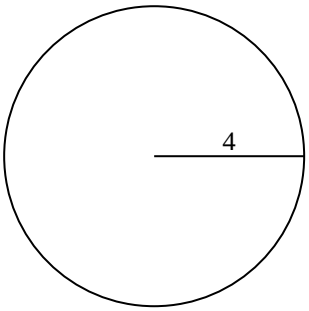

7)

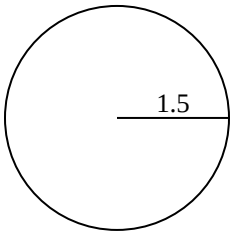

8)

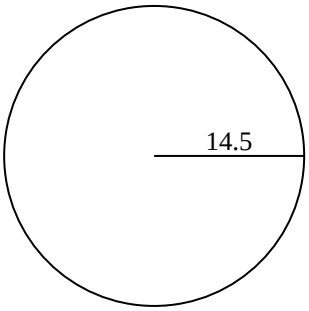

9)

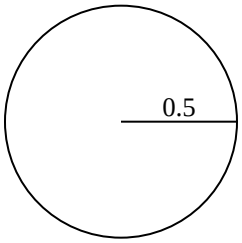

10)

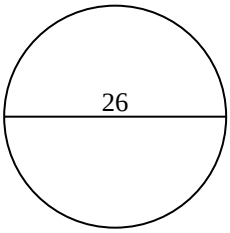

Answers

1. _____
2. _____
3. _____
4. _____
5. _____
6. _____
7. _____
8. _____
9. _____
10. _____

1-10	90	80	70	60	50	40	30	20	10	0

Finding the Circumference of a Circle

Name:

Find the circumference (in cm) of the circle. Circles are not to scale.

1)

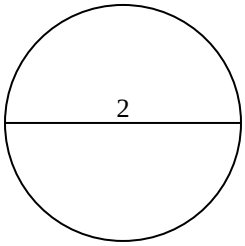

2)

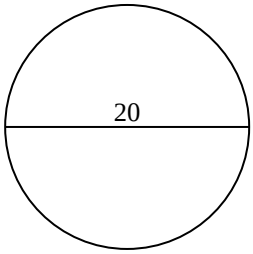

3)

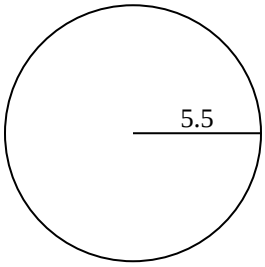

4)

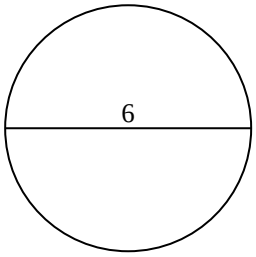

5)

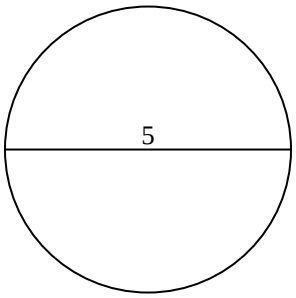

6)

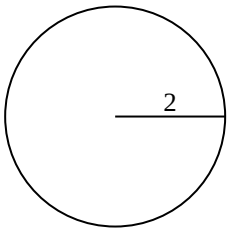

7)

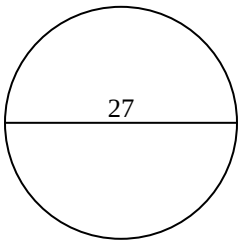

8)

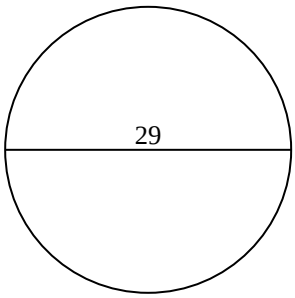

9)

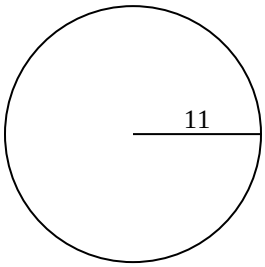

10)

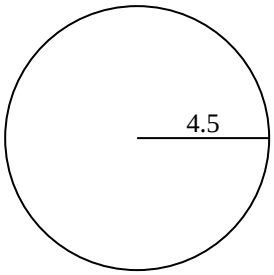

Answers

1. _____
2. _____
3. _____
4. _____
5. _____
6. _____
7. _____
8. _____
9. _____
10. _____

1-10	90	80	70	60	50	40	30	20	10	0

Finding the Circumference of a Circle

Name: **Answer Key**

Find the circumference (in cm) of the circle. Circles are not to scale.

1)

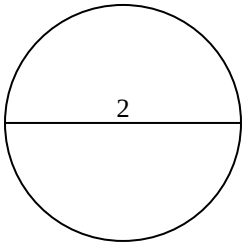

2)

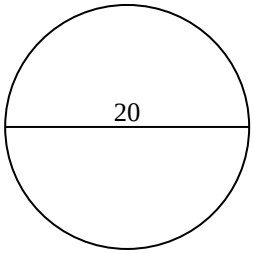

3)

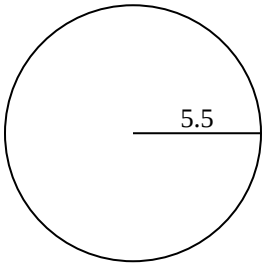

4)

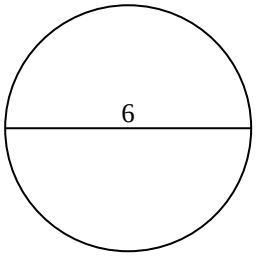

5)

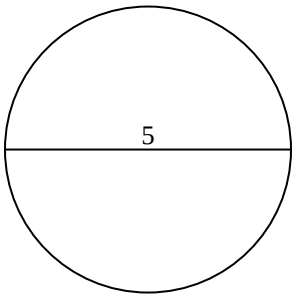

6)

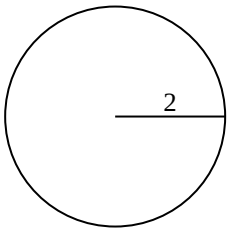

7)

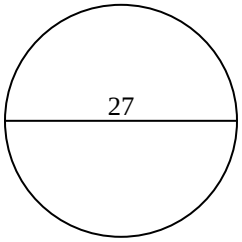

8)

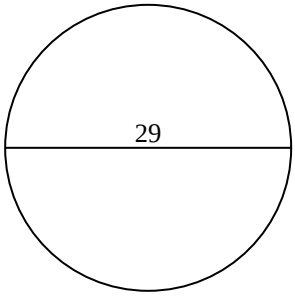

9)

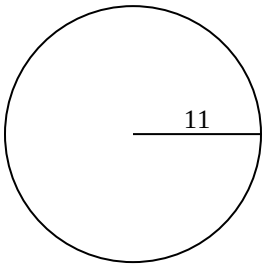

10)

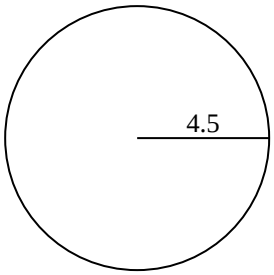

Answers

1. **6.28 cm**
2. **62.83 cm**
3. **34.56 cm**
4. **18.85 cm**
5. **15.71 cm**
6. **12.57 cm**
7. **84.82 cm**
8. **91.11 cm**
9. **69.12 cm**
10. **28.27 cm**

1-10	90	80	70	60	50	40	30	20	10	0

Finding the Circumference of a Circle Name:

Find the circumference (in cm) of the circle. Circles are not to scale.

12.57 cm	34.56 cm	18.85 cm	28.27 cm	91.11 cm
84.82 cm	6.28 cm	69.12 cm	15.71 cm	62.83 cm

1)

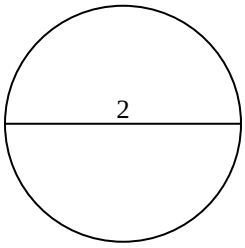

2)

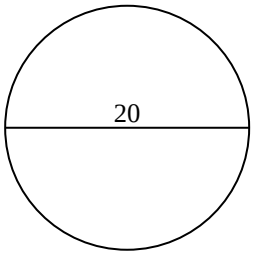

3)

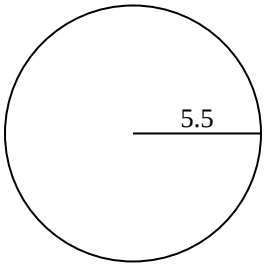

4)

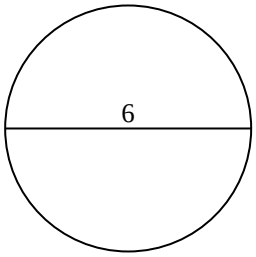

5)

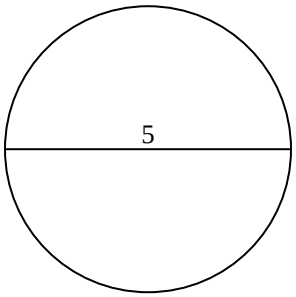

6)

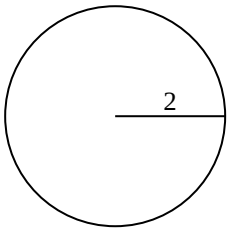

7)

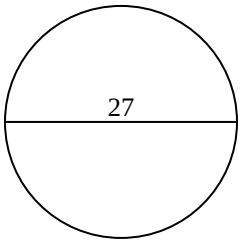

8)

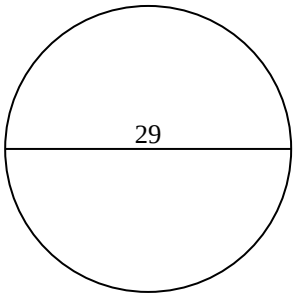

9)

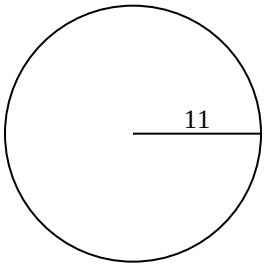

10)

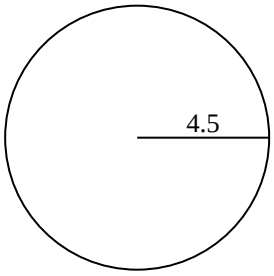

Answers

1. _____
2. _____
3. _____
4. _____
5. _____
6. _____
7. _____
8. _____
9. _____
10. _____

1-10	90	80	70	60	50	40	30	20	10	0

Finding the Circumference of a Circle

Name:

Find the circumference (in cm) of the circle. Circles are not to scale.

1)

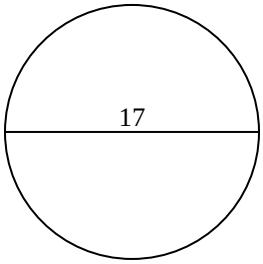

2)

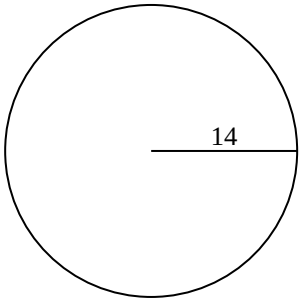

3)

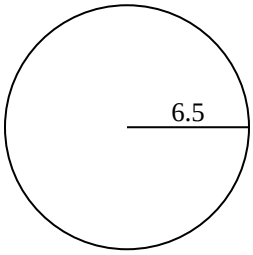

4)

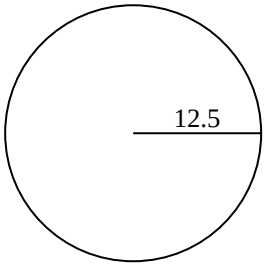

5)

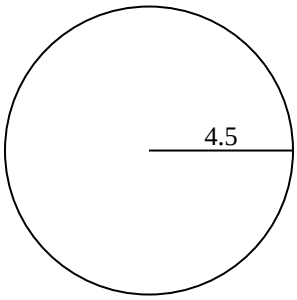

6)

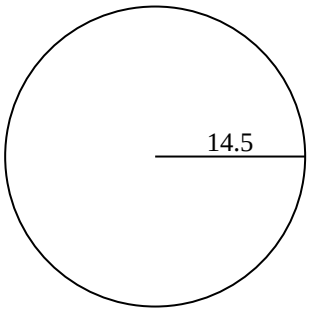

7)

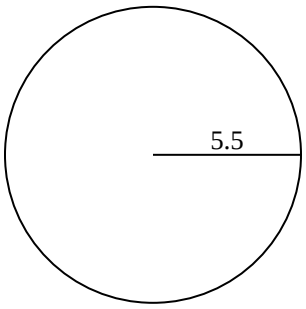

8)

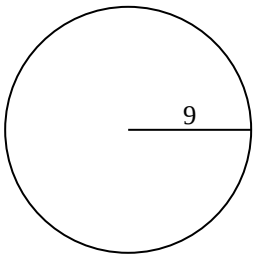

9)

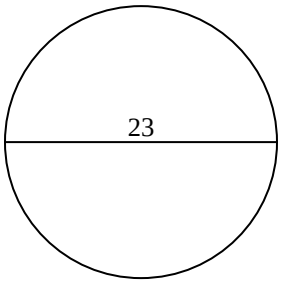

10)

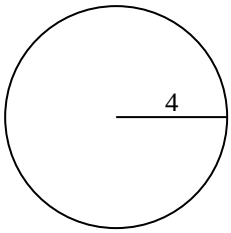

Answers

1. _____
2. _____
3. _____
4. _____
5. _____
6. _____
7. _____
8. _____
9. _____
10. _____

1-10	90	80	70	60	50	40	30	20	10	0

Finding the Circumference of a Circle Name: **Answer Key**

Find the circumference (in cm) of the circle. Circles are not to scale.

1)

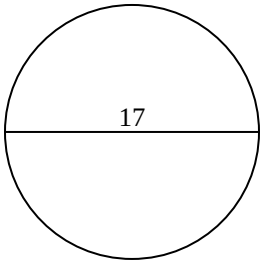

2)

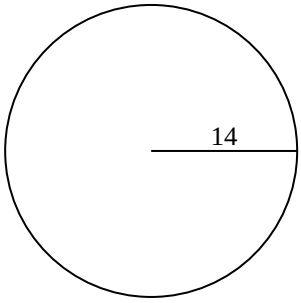

3)

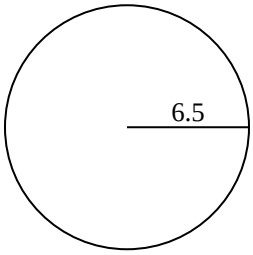

4)

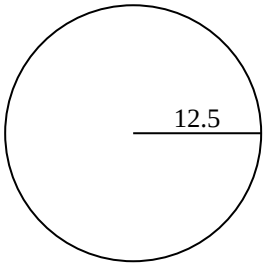

5)

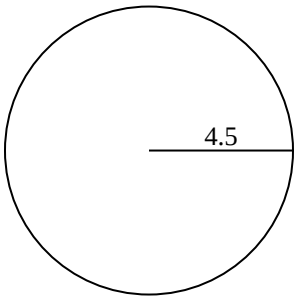

6)

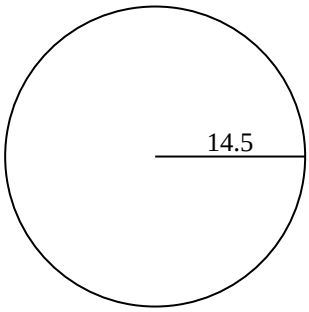

7)

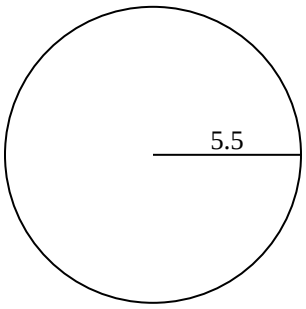

8)

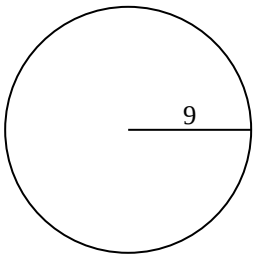

9)

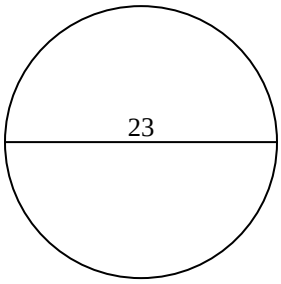

10)

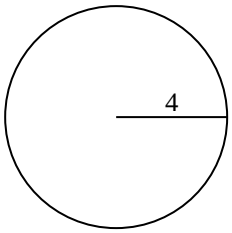

Answers

1. **53.41 cm**
2. **87.96 cm**
3. **40.84 cm**
4. **78.54 cm**
5. **28.27 cm**
6. **91.11 cm**
7. **34.56 cm**
8. **56.55 cm**
9. **72.26 cm**
10. **25.13 cm**

1-10	90	80	70	60	50	40	30	20	10	0

Finding the Circumference of a Circle

Name:

Find the circumference (in cm) of the circle. Circles are not to scale.

72.26 cm	40.84 cm	34.56 cm	53.41 cm	25.13 cm
28.27 cm	87.96 cm	78.54 cm	91.11 cm	56.55 cm

1)

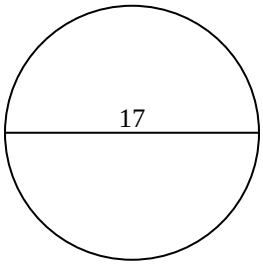

2)

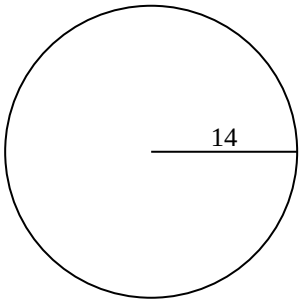

3)

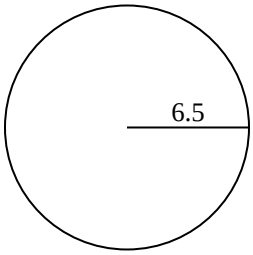

4)

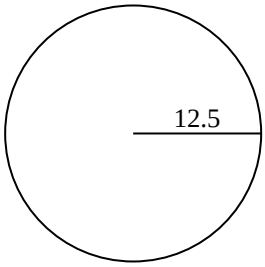

5)

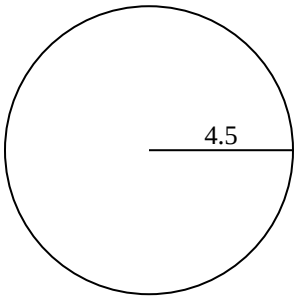

6)

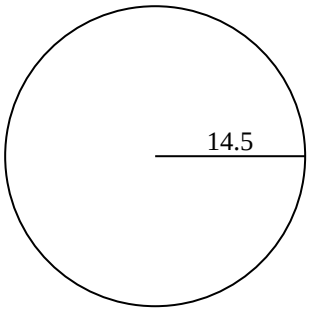

7)

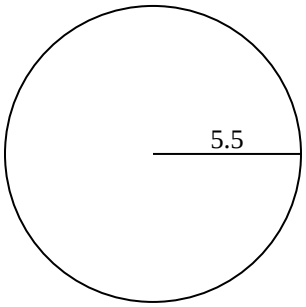

8)

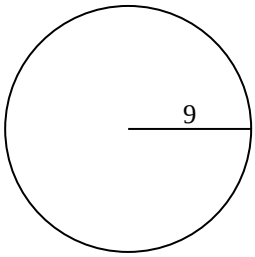

9)

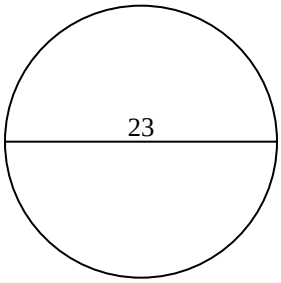

10)

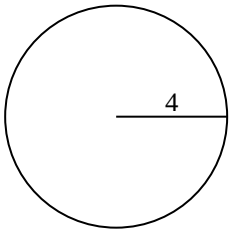

Answers

1. _____
2. _____
3. _____
4. _____
5. _____
6. _____
7. _____
8. _____
9. _____
10. _____

1-10	90	80	70	60	50	40	30	20	10	0

Finding the Circumference of a Circle Name:

Find the circumference (in cm) of the circle. Circles are not to scale.

1)

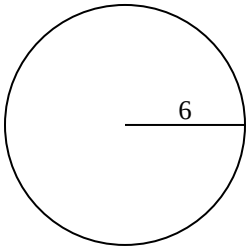

2)

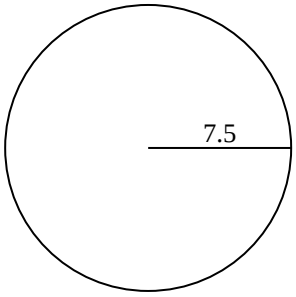

3)

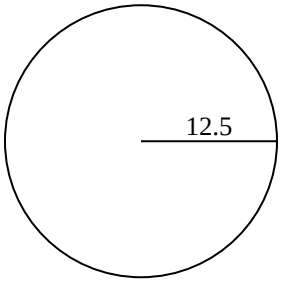

4)

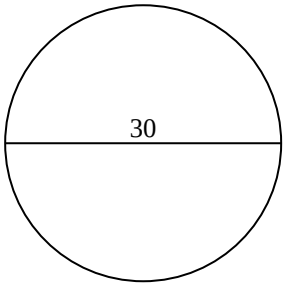

5)

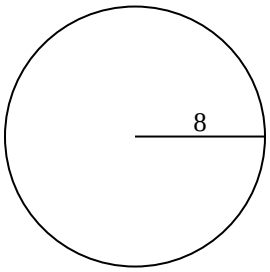

6)

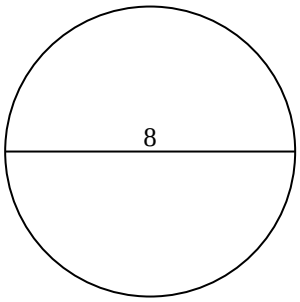

7)

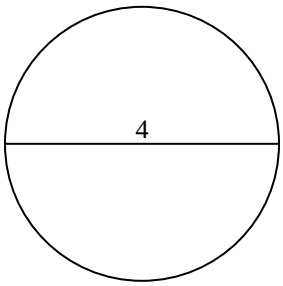

8)

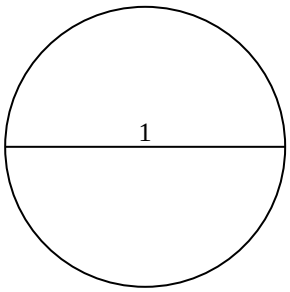

9)

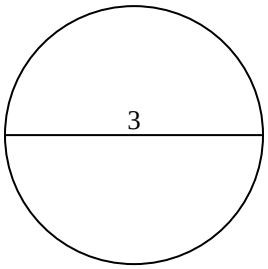

10)

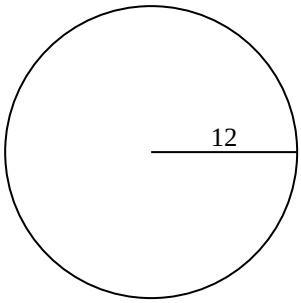

Answers

1. _____
2. _____
3. _____
4. _____
5. _____
6. _____
7. _____
8. _____
9. _____
10. _____

1-10	90	80	70	60	50	40	30	20	10	0

Finding the Circumference of a Circle

Name: **Answer Key**

Find the circumference (in cm) of the circle. Circles are not to scale.

1)

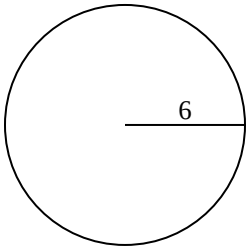

2)

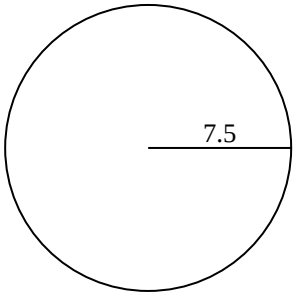

3)

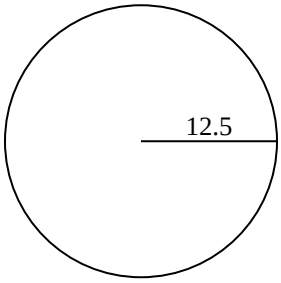

4)

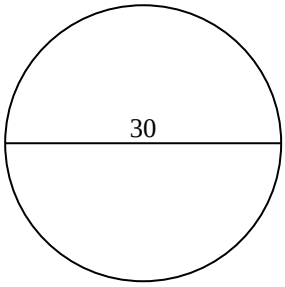

5)

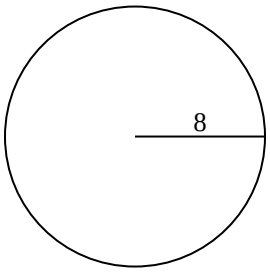

6)

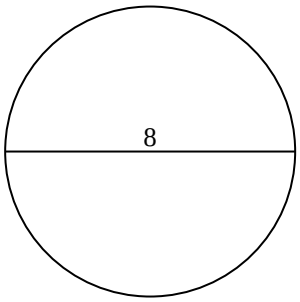

7)

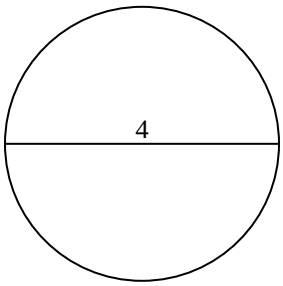

8)

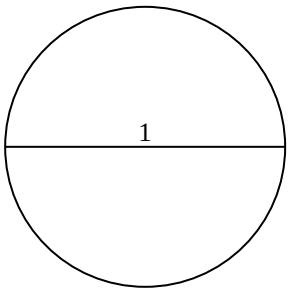

9)

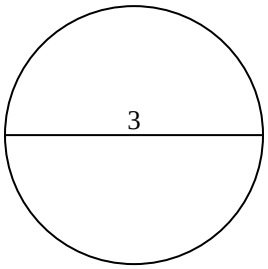

10)

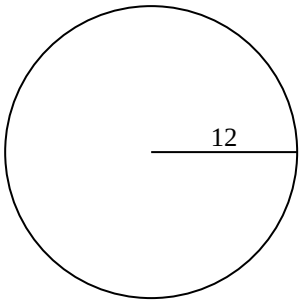

Answers

1. **37.7 cm**
2. **47.12 cm**
3. **78.54 cm**
4. **94.25 cm**
5. **50.27 cm**
6. **25.13 cm**
7. **12.57 cm**
8. **3.14 cm**
9. **9.42 cm**
10. **75.4 cm**

1-10	90	80	70	60	50	40	30	20	10	0

Finding the Circumference of a Circle

Name:

Find the circumference (in cm) of the circle. Circles are not to scale.

12.57 cm	75.4 cm	25.13 cm	94.25 cm	50.27 cm
9.42 cm	78.54 cm	37.7 cm	47.12 cm	3.14 cm

1)

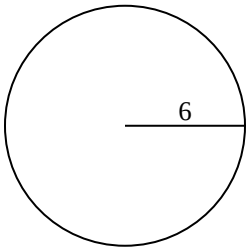

2)

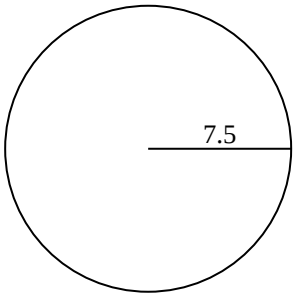

3)

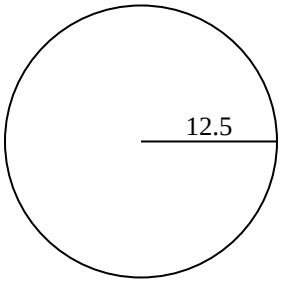

4)

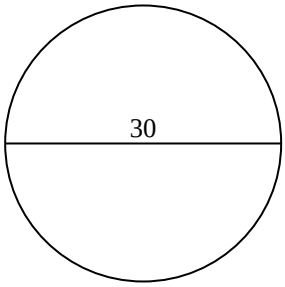

5)

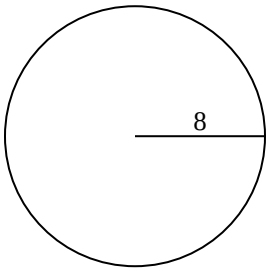

6)

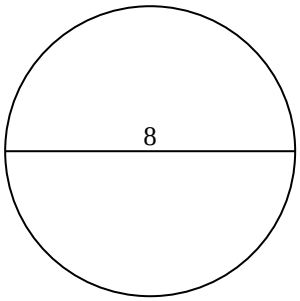

7)

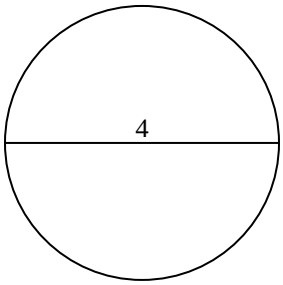

8)

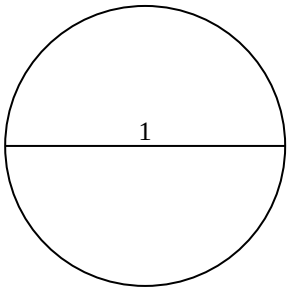

9)

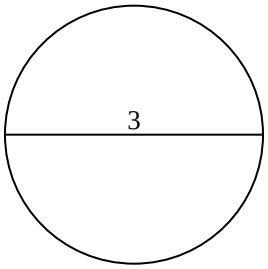

10)

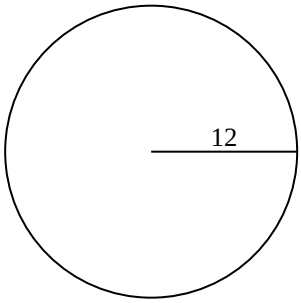

Answers

1. _____
2. _____
3. _____
4. _____
5. _____
6. _____
7. _____
8. _____
9. _____
10. _____

1-10	90	80	70	60	50	40	30	20	10	0

Finding the Circumference of a Circle

Name:

Find the circumference (in cm) of the circle. Circles are not to scale.

1)

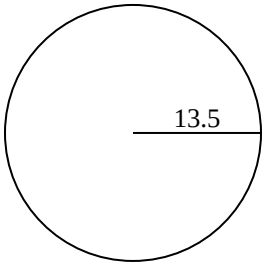

2)

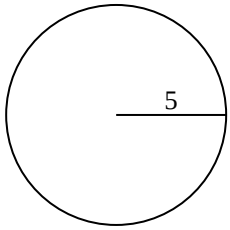

3)

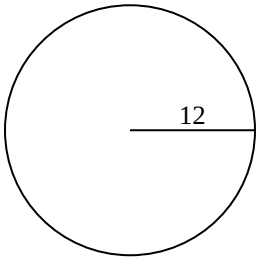

4)

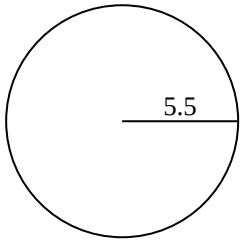

5)

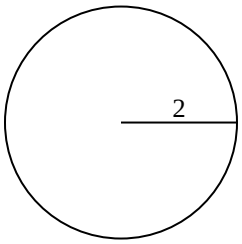

6)

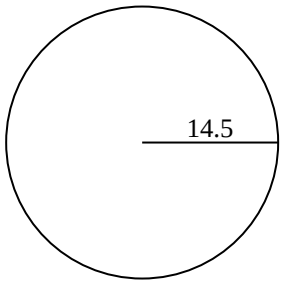

7)

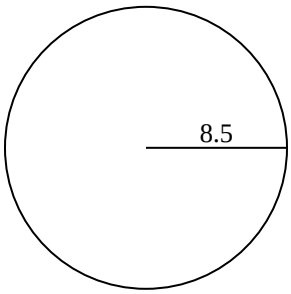

8)

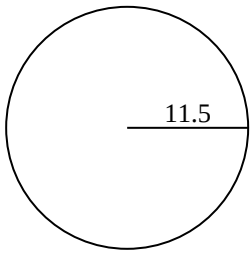

9)

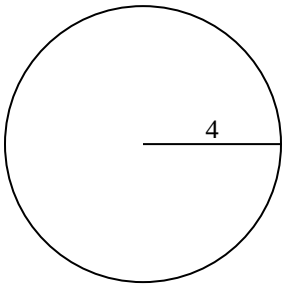

10)

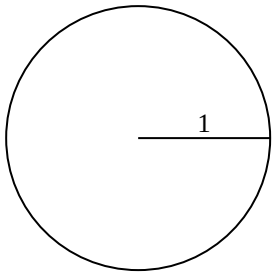

Answers

1. _____
2. _____
3. _____
4. _____
5. _____
6. _____
7. _____
8. _____
9. _____
10. _____

1-10	90	80	70	60	50	40	30	20	10	0

Finding the Circumference of a Circle

Name: **Answer Key**

Find the circumference (in cm) of the circle. Circles are not to scale.

1)

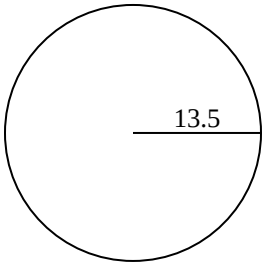

2)

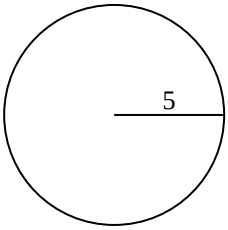

3)

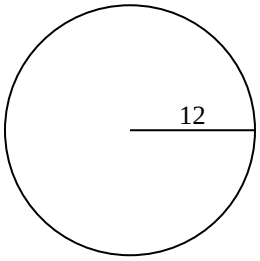

4)

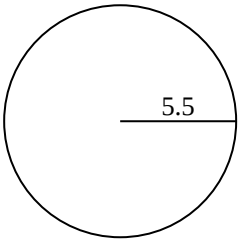

5)

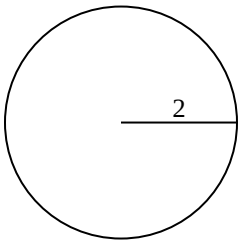

6)

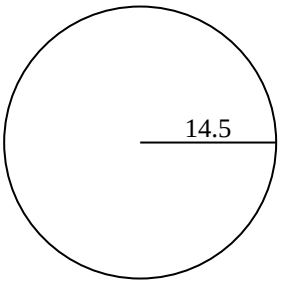

7)

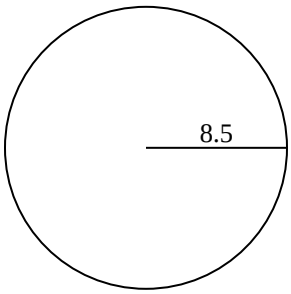

8)

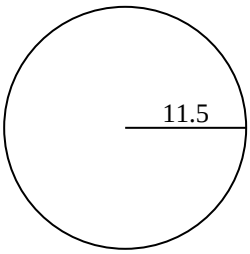

9)

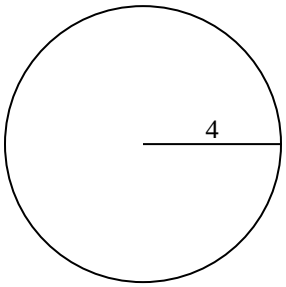

10)

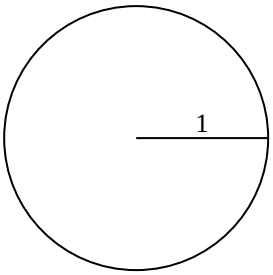

Answers

1. **84.82 cm**
2. **31.42 cm**
3. **75.4 cm**
4. **34.56 cm**
5. **12.57 cm**
6. **91.11 cm**
7. **53.41 cm**
8. **72.26 cm**
9. **25.13 cm**
10. **6.28 cm**

1-10	90	80	70	60	50	40	30	20	10	0

Finding the Circumference of a Circle

Name:

Find the circumference (in cm) of the circle. Circles are not to scale.

53.41 cm	84.82 cm	31.42 cm	72.26 cm	34.56 cm
12.57 cm	75.4 cm	91.11 cm	6.28 cm	25.13 cm

1)

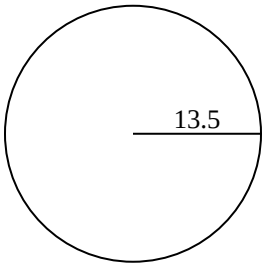

2)

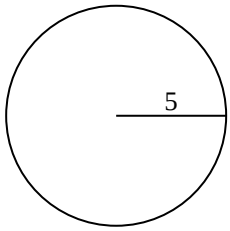

3)

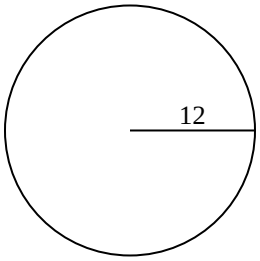

4)

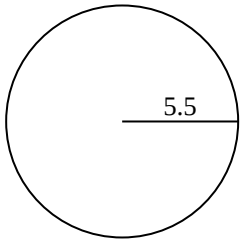

5)

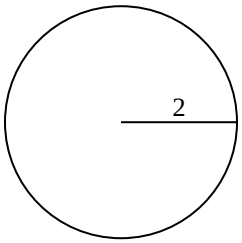

6)

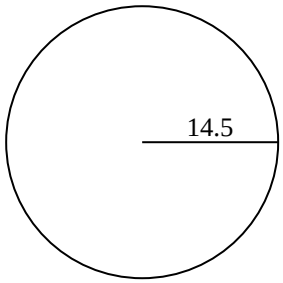

7)

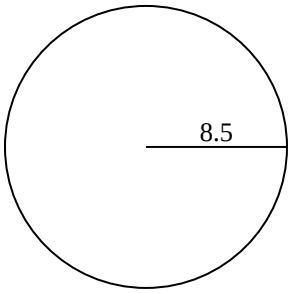

8)

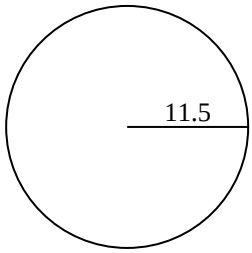

9)

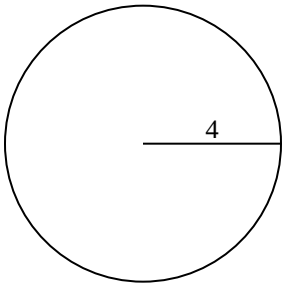

10)

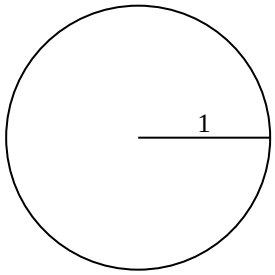

Answers

1. _____
2. _____
3. _____
4. _____
5. _____
6. _____
7. _____
8. _____
9. _____
10. _____

1-10	90	80	70	60	50	40	30	20	10	0