Determining Area with Full Blocks

Name:

Find the area of each shaded section. Each block is 1 square unit (u^2).

1)

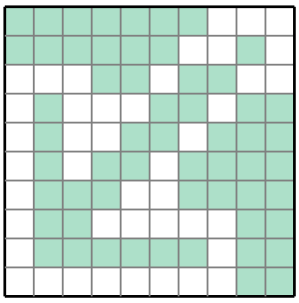

2)

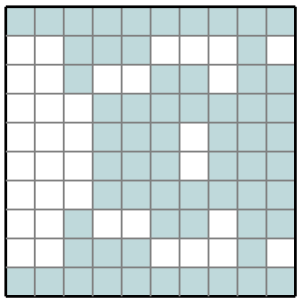

3)

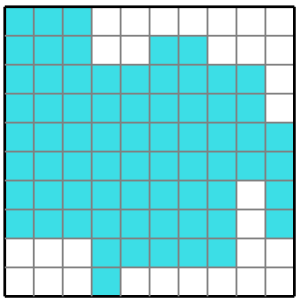

4)

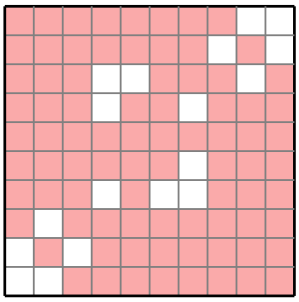

5)

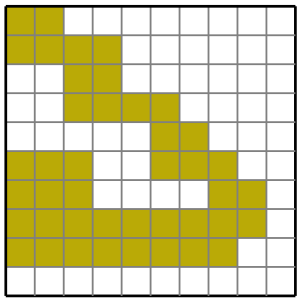

6)

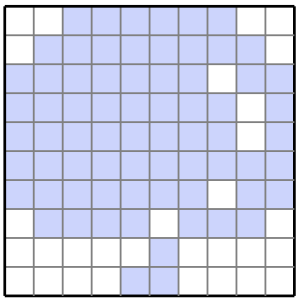

7)

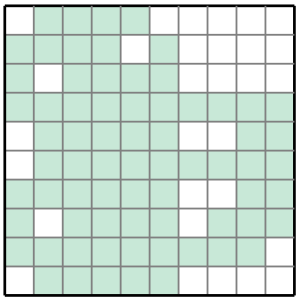

8)

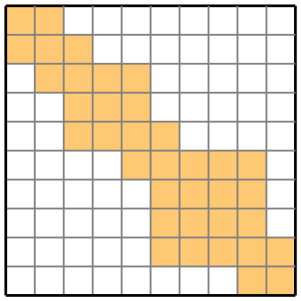

9)

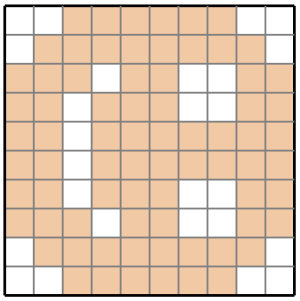

10)

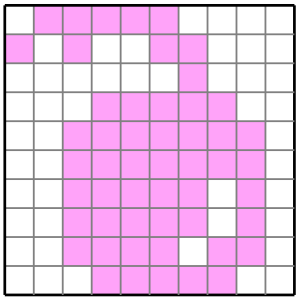

11)

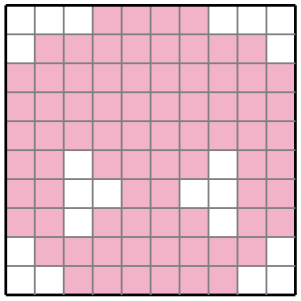

12)

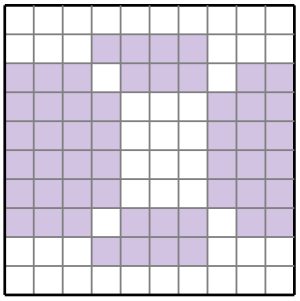

Answers

1. _____
2. _____
3. _____
4. _____
5. _____
6. _____
7. _____
8. _____
9. _____
10. _____
11. _____
12. _____

1-10	92	83	75	67	58	50	42	33	25	17
11-12	8	0								

Determining Area with Full Blocks

Name: **Answer Key**

Find the area of each shaded section. Each block is 1 square unit (u^2).

1)

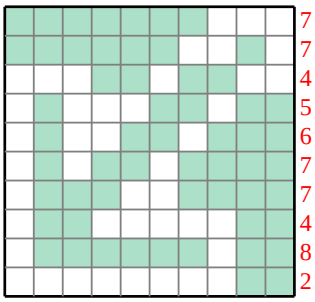

2)

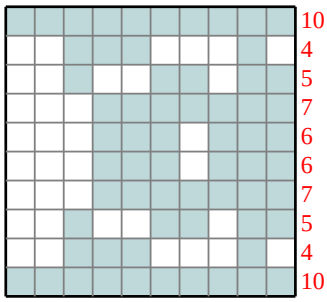

3)

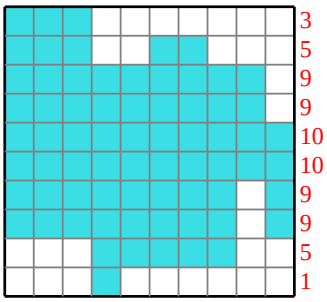

4)

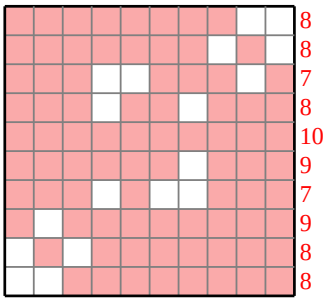

5)

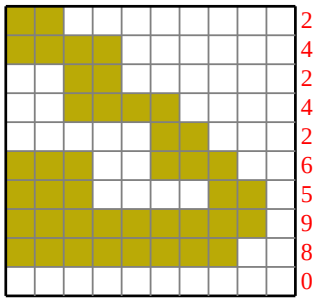

6)

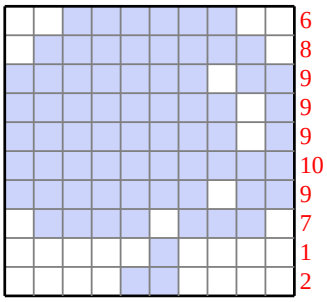

7)

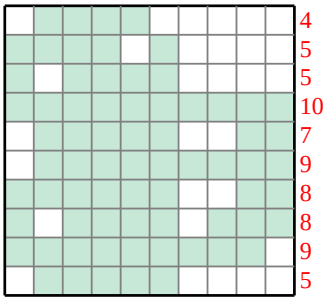

8)

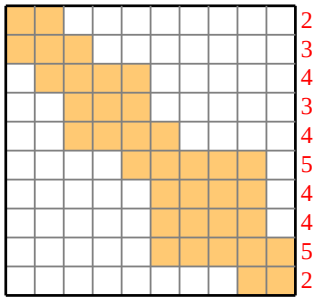

9)

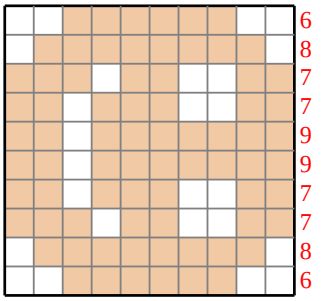

10)

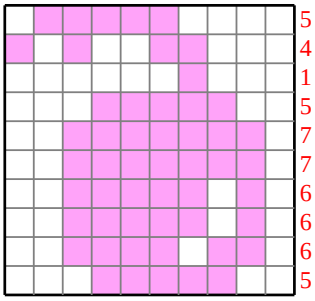

11)

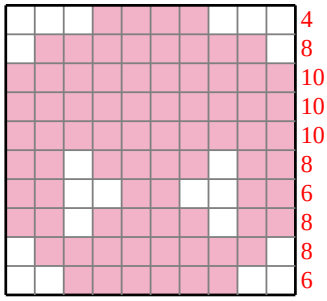

12)

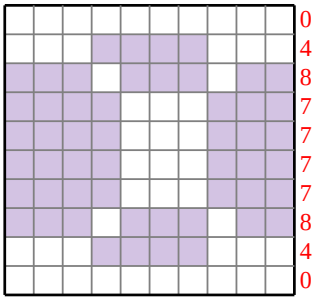

Answers

1. **57 u^2**
2. **64 u^2**
3. **70 u^2**
4. **82 u^2**
5. **42 u^2**
6. **70 u^2**
7. **70 u^2**
8. **36 u^2**
9. **74 u^2**
10. **52 u^2**
11. **78 u^2**
12. **52 u^2**

1-10	92	83	75	67	58	50	42	33	25	17
11-12	8	0								