Finding the Area of a Circle

Name:

Find the area of the circle. Round to the nearest 10th.

1)

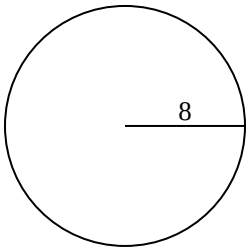

2)

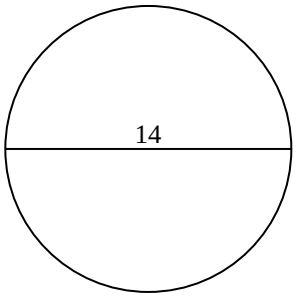

3)

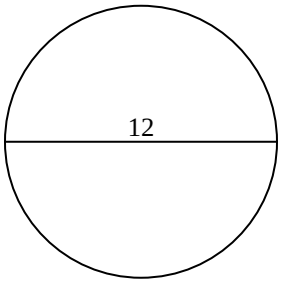

4)

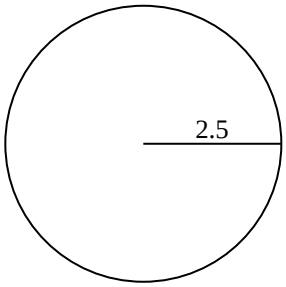

5)

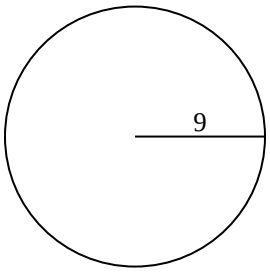

6)

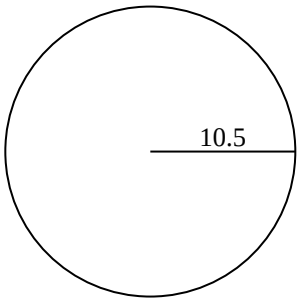

7)

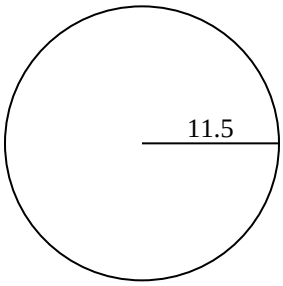

8)

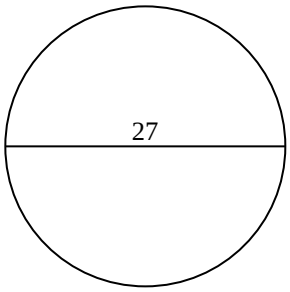

9)

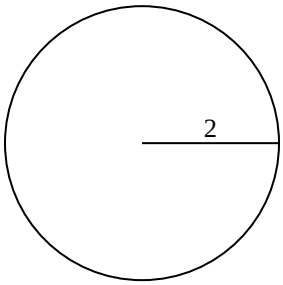

10)

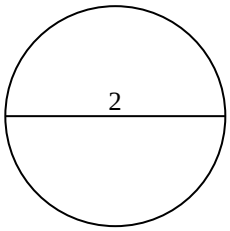

Answers

1. _____
2. _____
3. _____
4. _____
5. _____
6. _____
7. _____
8. _____
9. _____
10. _____

1-10	90	80	70	60	50	40	30	20	10	0

Finding the Area of a Circle

Name: **Answer Key**

Find the area of the circle. Round to the nearest 10th.

1)

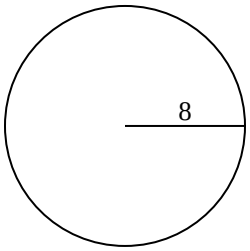

2)

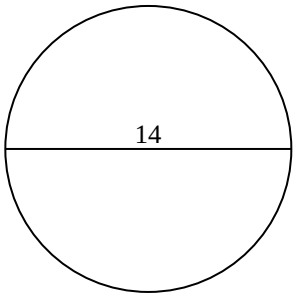

3)

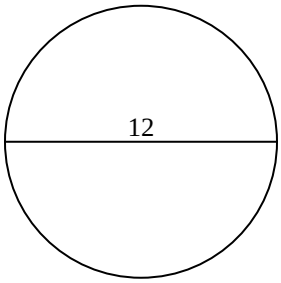

4)

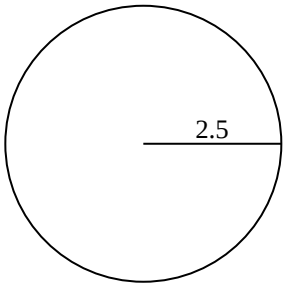

5)

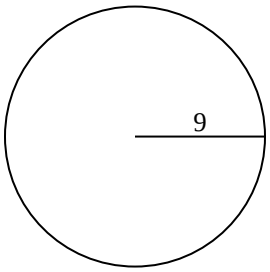

6)

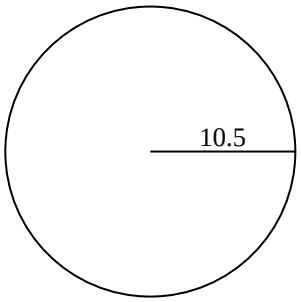

7)

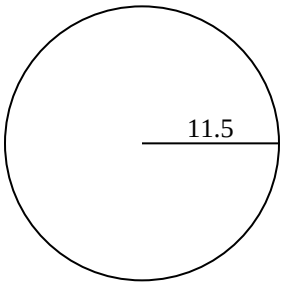

8)

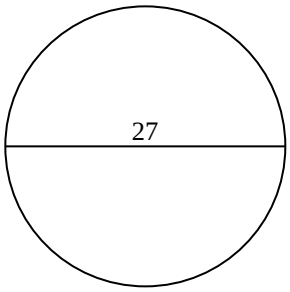

9)

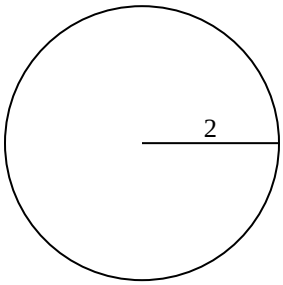

10)

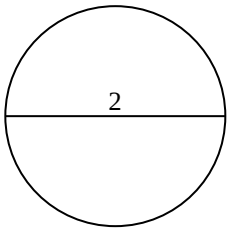

Answers

1. **201.1**
2. **153.9**
3. **113.1**
4. **19.6**
5. **254.5**
6. **346.4**
7. **415.5**
8. **572.6**
9. **12.6**
10. **3.1**

1-10	90	80	70	60	50	40	30	20	10	0

Finding the Area of a Circle

Name:

Find the area of the circle. Round to the nearest 10th.

572.6	113.1	415.5	12.6	346.4
201.1	153.9	254.5	19.6	

1)

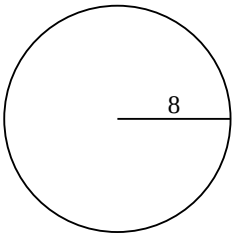

2)

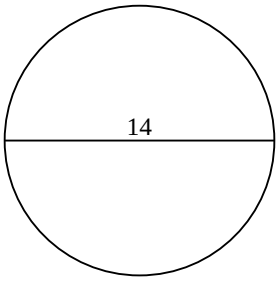

3)

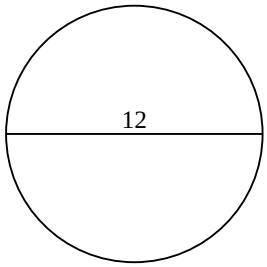

4)

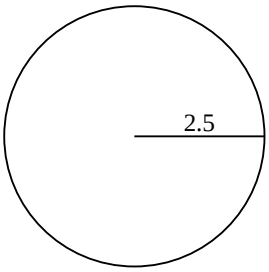

5)

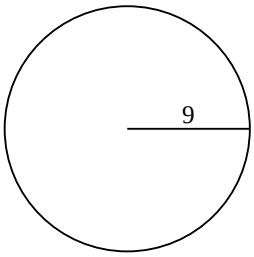

6)

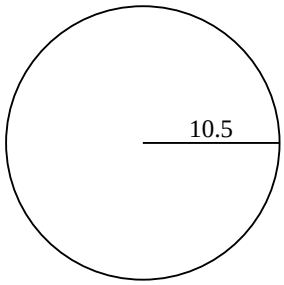

7)

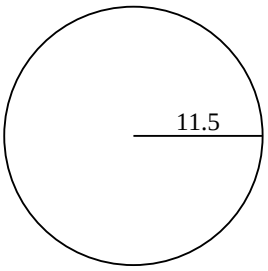

8)

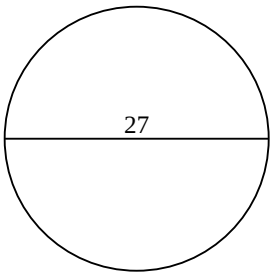

9)

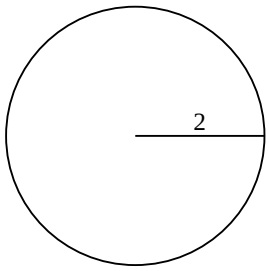

Answers

1. _____
2. _____
3. _____
4. _____
5. _____
6. _____
7. _____
8. _____
9. _____