World Geography - Continents Name:

Using the map below, determine which letter represents each continent or ocean.

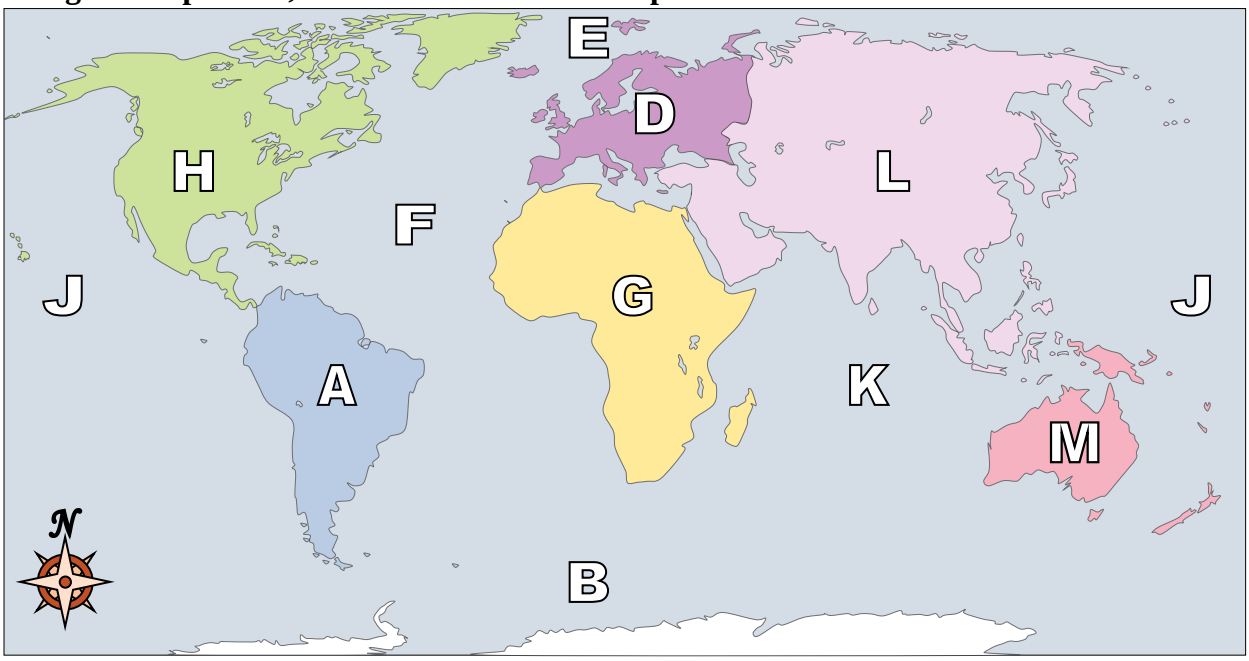

1) North America _____

2) Africa _____

3) Australia _____

4) Europe _____

5) Atlantic Ocean _____

6) Asia _____

7) Indian Ocean _____

8) Antarctica _____

9) South America _____

10) Southern Ocean _____

11) Pacific Ocean _____

12) Arctic Ocean _____

13) If you were in South America and flew east to Australia which continent would you fly over?
A. Antarctica B. Asia C. Africa D. North America

14) If you were in Europe and went south which continent would you end up in?
A. Africa B. South America C. North America D. Australia

15) Which continent is not touching any other continents?
A. Antarctica B. Europe C. Africa D. Asia

16) Which ocean touches South America's western border?
A. Arctic Ocean B. Pacific Ocean C. Indian Ocean D. Atlantic Ocean

17) Which of these oceans is not touching North America?
A. Indian Ocean B. Pacific Ocean C. Arctic Ocean D. Atlantic Ocean

Answers

1. _____
2. _____
3. _____
4. _____
5. _____
6. _____
7. _____
8. _____
9. _____
10. _____
11. _____
12. _____
13. _____
14. _____
15. _____
16. _____
17. _____

1-10	94	88	82	76	71	65	59	53	47	41
11-17	35	29	24	18	12	6	0			

World Geography - Continents

Name: **Answer Key**

Using the map below, determine which letter represents each continent or ocean.

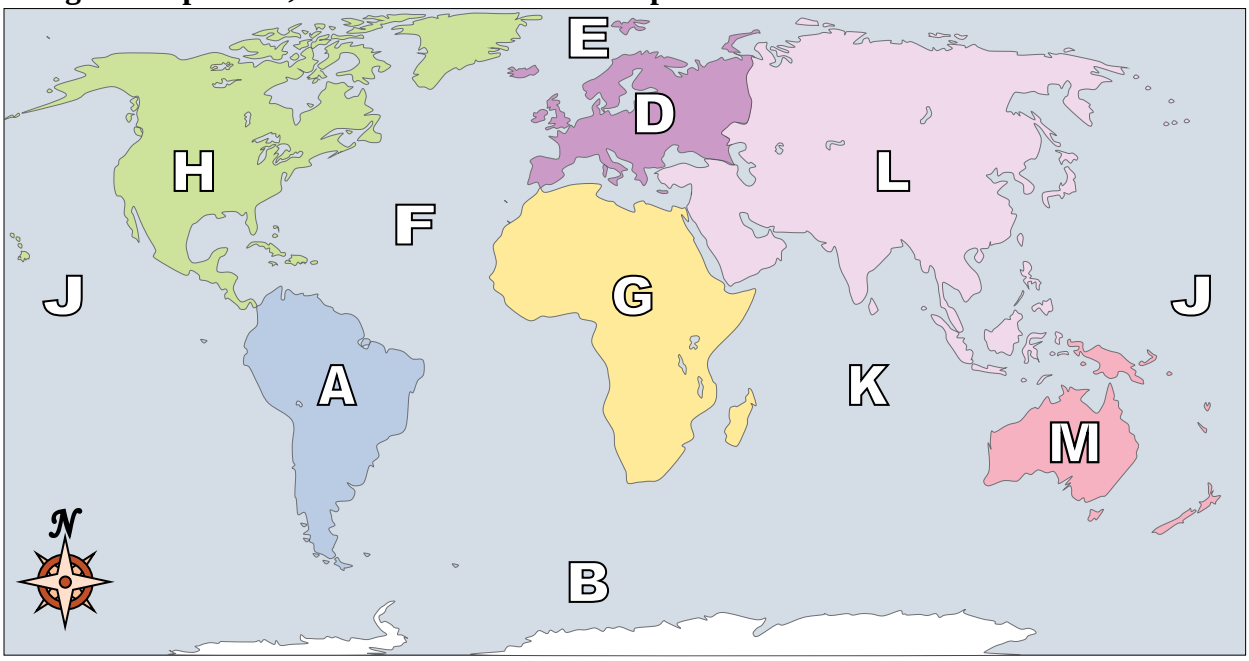

1) North America H

2) Africa G

3) Australia M

4) Europe D

5) Atlantic Ocean F

6) Asia L

7) Indian Ocean K

8) Antarctica C

9) South America A

10) Southern Ocean B

11) Pacific Ocean J

12) Arctic Ocean E

13) If you were in South America and flew east to Australia which continent would you fly over?
A. Antarctica B. Asia C. Africa D. North America

14) If you were in Europe and went south which continent would you end up in?
A. Africa B. South America C. North America D. Australia

15) Which continent is not touching any other continents?
A. Antarctica B. Europe C. Africa D. Asia

16) Which ocean touches South America's western border?
A. Arctic Ocean B. Pacific Ocean C. Indian Ocean D. Atlantic Ocean

17) Which of these oceans is not touching North America?
A. Indian Ocean B. Pacific Ocean C. Arctic Ocean D. Atlantic Ocean

Answers

1. H
2. G
3. M
4. D
5. F
6. L
7. K
8. C
9. A
10. B
11. J
12. E
13. C
14. A
15. A
16. B
17. A

1-10	94	88	82	76	71	65	59	53	47	41
11-17	35	29	24	18	12	6	0			

World Geography - Continents Name:

Using the map below, determine which letter represents each continent or ocean.

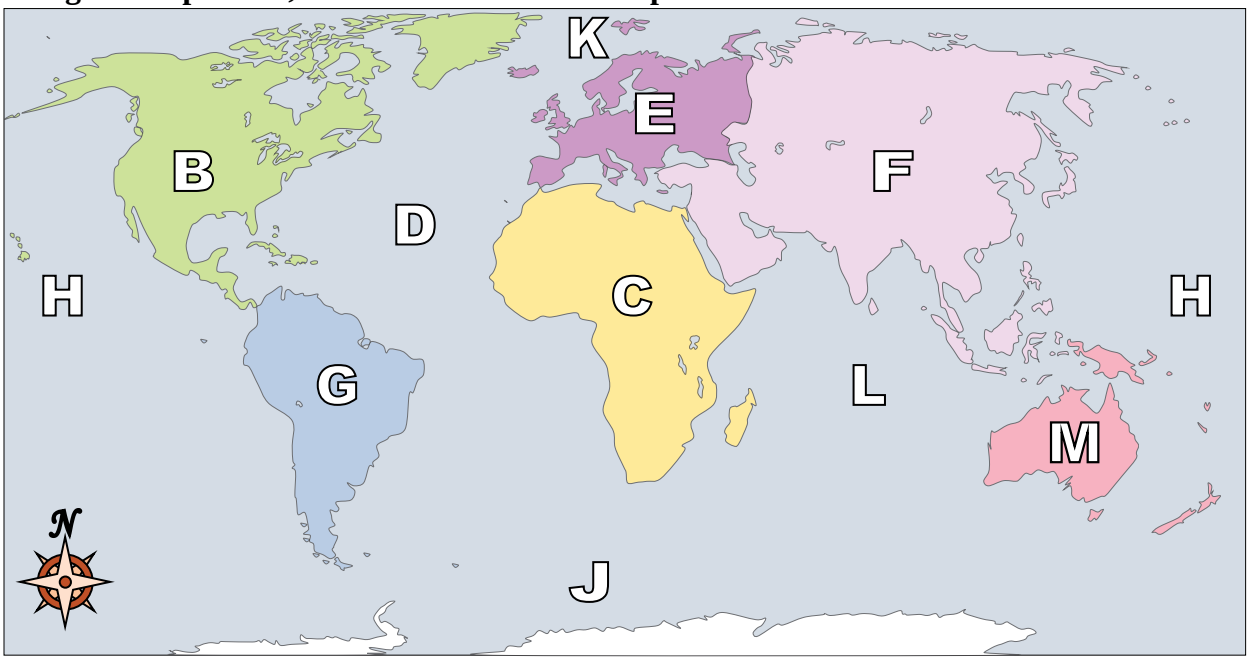

1) North America _____

2) Africa _____

3) Southern Ocean _____

4) Pacific Ocean _____

5) Atlantic Ocean _____

6) Indian Ocean _____

7) Australia _____

8) Asia _____

9) Arctic Ocean _____

10) Europe _____

11) South America _____

12) Antarctica _____

13) Which ocean touches Africa's eastern border?
A. Indian Ocean B. Pacific Ocean C. Arctic Ocean D. Atlantic Ocean

14) Which ocean touches South America's western border?
A. Pacific Ocean B. Arctic Ocean C. Atlantic Ocean D. Indian Ocean

15) If you were in Europe and went south which continent would you end up in?
A. Africa B. Australia C. North America D. South America

16) If you were in Europe and went east which continent would you end up in?
A. Asia B. South America C. North America D. Africa

17) If you were in South America and flew east to Australia which continent would you fly over?
A. Europe B. Africa C. Asia D. North America

Answers

1. _____
2. _____
3. _____
4. _____
5. _____
6. _____
7. _____
8. _____
9. _____
10. _____
11. _____
12. _____
13. _____
14. _____
15. _____
16. _____
17. _____

1-10	94	88	82	76	71	65	59	53	47	41
11-17	35	29	24	18	12	6	0			

World Geography - Continents

Name: **Answer Key**

Using the map below, determine which letter represents each continent or ocean.

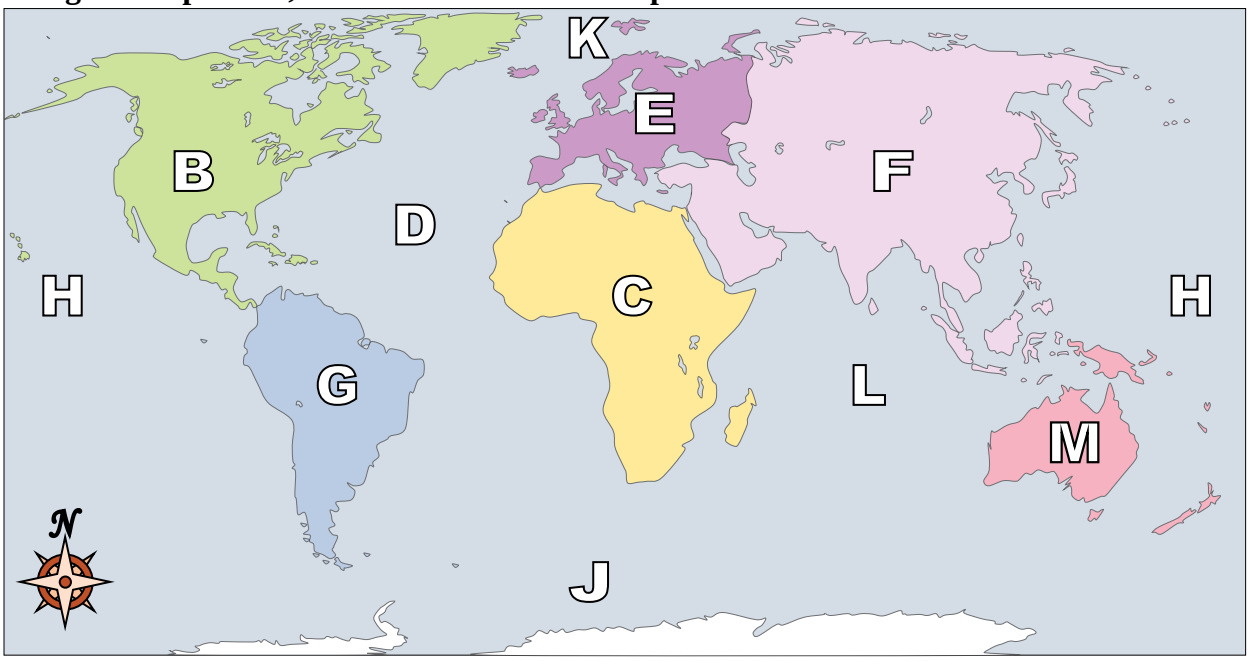

1) North America B

2) Africa C

3) Southern Ocean J

4) Pacific Ocean H

5) Atlantic Ocean D

6) Indian Ocean L

7) Australia M

8) Asia F

9) Arctic Ocean K

10) Europe E

11) South America G

12) Antarctica A

13) Which ocean touches Africa's eastern border?
A. Indian Ocean B. Pacific Ocean C. Arctic Ocean D. Atlantic Ocean

14) Which ocean touches South America's western border?
A. Pacific Ocean B. Arctic Ocean C. Atlantic Ocean D. Indian Ocean

15) If you were in Europe and went south which continent would you end up in?
A. Africa B. Australia C. North America D. South America

16) If you were in Europe and went east which continent would you end up in?
A. Asia B. South America C. North America D. Africa

17) If you were in South America and flew east to Australia which continent would you fly over?
A. Europe B. Africa C. Asia D. North America

Answers

1. B
2. C
3. J
4. H
5. D
6. L
7. M
8. F
9. K
10. E
11. G
12. A
13. A
14. A
15. A
16. A
17. B

1-10	94	88	82	76	71	65	59	53	47	41
11-17	35	29	24	18	12	6	0			

World Geography - Continents Name:

Using the map below, determine which letter represents each continent or ocean.

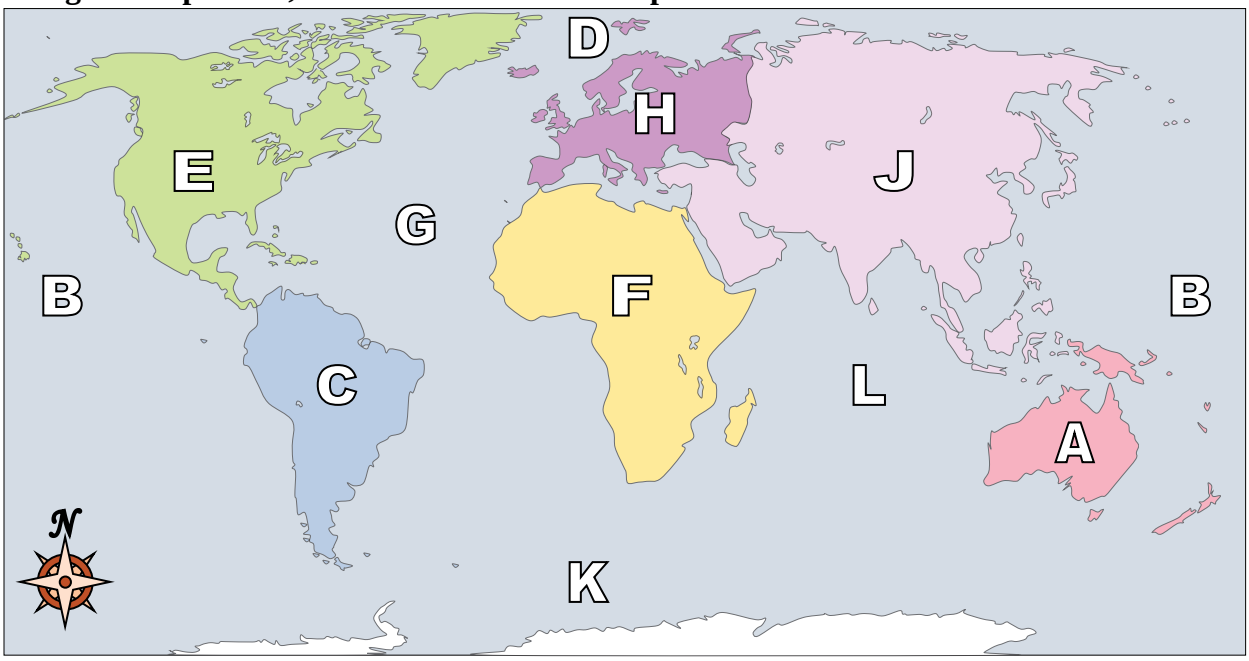

1) Africa _____

2) North America _____

3) Arctic Ocean _____

4) Indian Ocean _____

5) South America _____

6) Pacific Ocean _____

7) Southern Ocean _____

8) Antarctica _____

9) Asia _____

10) Australia _____

11) Europe _____

12) Atlantic Ocean _____

13) Which ocean touches South America's western border?
A. Indian Ocean B. Atlantic Ocean C. Arctic Ocean D. Pacific Ocean

14) If you were in Europe and went east which continent would you end up in?
A. Asia B. Africa C. North America D. South America

15) Which ocean touches South America's eastern border?
A. Atlantic Ocean B. Pacific Ocean C. Arctic Ocean D. Indian Ocean

16) Which ocean touches Africa's eastern border?
A. Pacific Ocean B. Atlantic Ocean C. Arctic Ocean D. Indian Ocean

17) If you were in Europe and went south which continent would you end up in?
A. Australia B. Asia C. Africa D. North America

Answers

1. _____
2. _____
3. _____
4. _____
5. _____
6. _____
7. _____
8. _____
9. _____
10. _____
11. _____
12. _____
13. _____
14. _____
15. _____
16. _____
17. _____

1-10	94	88	82	76	71	65	59	53	47	41
11-17	35	29	24	18	12	6	0			

World Geography - Continents

Name: **Answer Key**

Using the map below, determine which letter represents each continent or ocean.

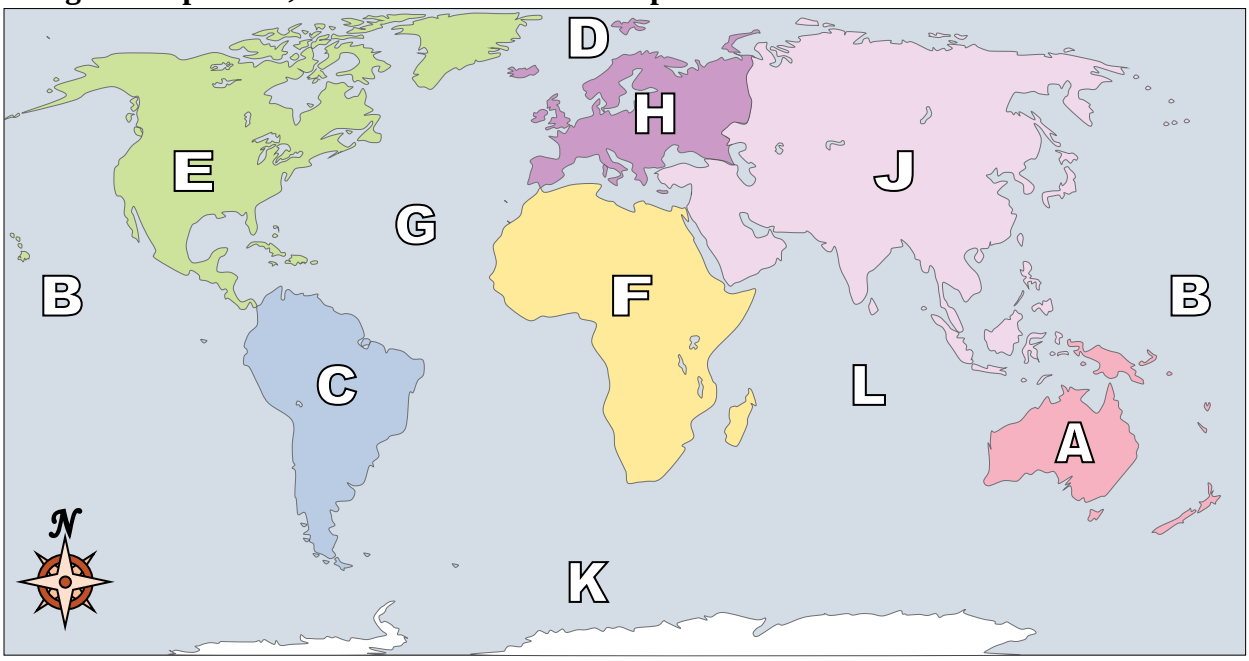

1) Africa F

2) North America E

3) Arctic Ocean D

4) Indian Ocean L

5) South America C

6) Pacific Ocean B

7) Southern Ocean K

8) Antarctica M

9) Asia J

10) Australia A

11) Europe H

12) Atlantic Ocean G

13) Which ocean touches South America's western border?
A. Indian Ocean B. Atlantic Ocean C. Arctic Ocean D. Pacific Ocean

14) If you were in Europe and went east which continent would you end up in?
A. Asia B. Africa C. North America D. South America

15) Which ocean touches South America's eastern border?
A. Atlantic Ocean B. Pacific Ocean C. Arctic Ocean D. Indian Ocean

16) Which ocean touches Africa's eastern border?
A. Pacific Ocean B. Atlantic Ocean C. Arctic Ocean D. Indian Ocean

17) If you were in Europe and went south which continent would you end up in?
A. Australia B. Asia C. Africa D. North America

Answers

1. F
2. E
3. D
4. L
5. C
6. B
7. K
8. M
9. J
10. A
11. H
12. G
13. D
14. A
15. A
16. D
17. C

1-10	94	88	82	76	71	65	59	53	47	41
11-17	35	29	24	18	12	6	0			

World Geography - Continents Name:

Using the map below, determine which letter represents each continent or ocean.

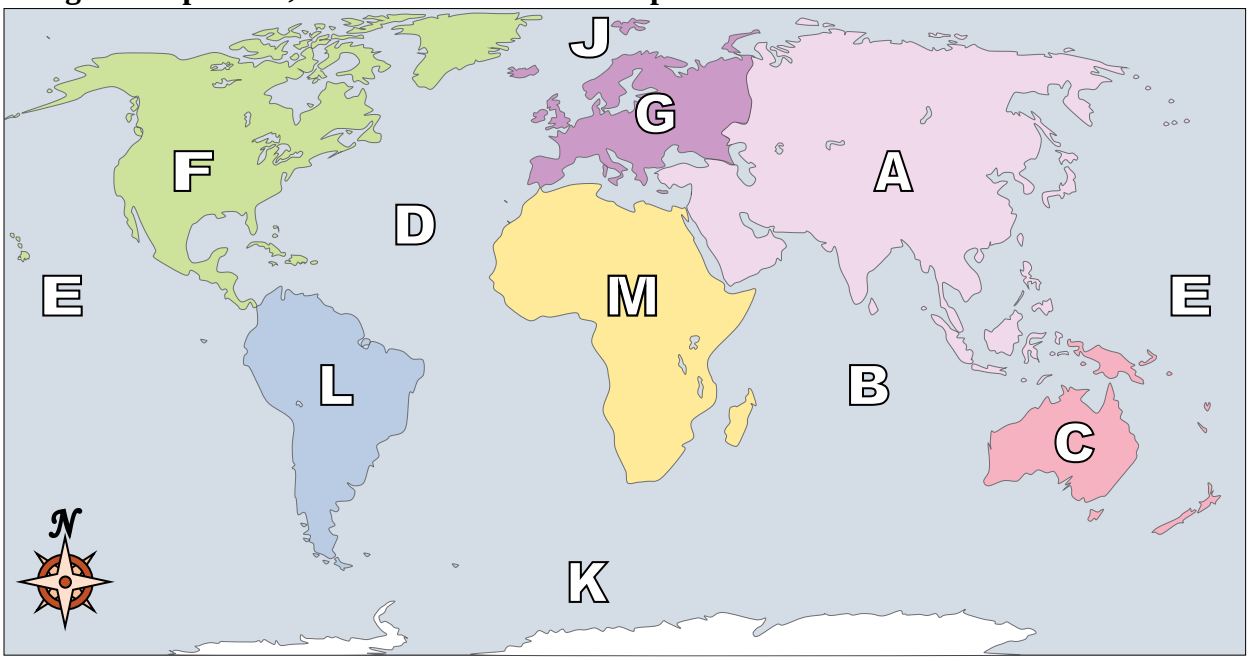

1) Atlantic Ocean _____

2) Antarctica _____

3) Australia _____

4) Southern Ocean _____

5) Asia _____

6) Europe _____

7) South America _____

8) Indian Ocean _____

9) Pacific Ocean _____

10) Arctic Ocean _____

11) Africa _____

12) North America _____

13) Which ocean touches South America's western border?
A. Pacific Ocean B. Arctic Ocean C. Indian Ocean D. Atlantic Ocean

14) Which of these continents is closest to Europe?
A. Africa B. South America C. Australia D. Antarctica

15) Which ocean touches Africa's eastern border?
A. Arctic Ocean B. Indian Ocean C. Atlantic Ocean D. Pacific Ocean

16) Which of these oceans is not touching North America?
A. Indian Ocean B. Atlantic Ocean C. Pacific Ocean D. Arctic Ocean

17) If you were in Africa and went south which continent would you end up in?
A. North America B. Antarctica C. Australia D. South America

Answers

1. _____
2. _____
3. _____
4. _____
5. _____
6. _____
7. _____
8. _____
9. _____
10. _____
11. _____
12. _____
13. _____
14. _____
15. _____
16. _____
17. _____

1-10	94	88	82	76	71	65	59	53	47	41
11-17	35	29	24	18	12	6	0			

World Geography - Continents

Name: **Answer Key**

Using the map below, determine which letter represents each continent or ocean.

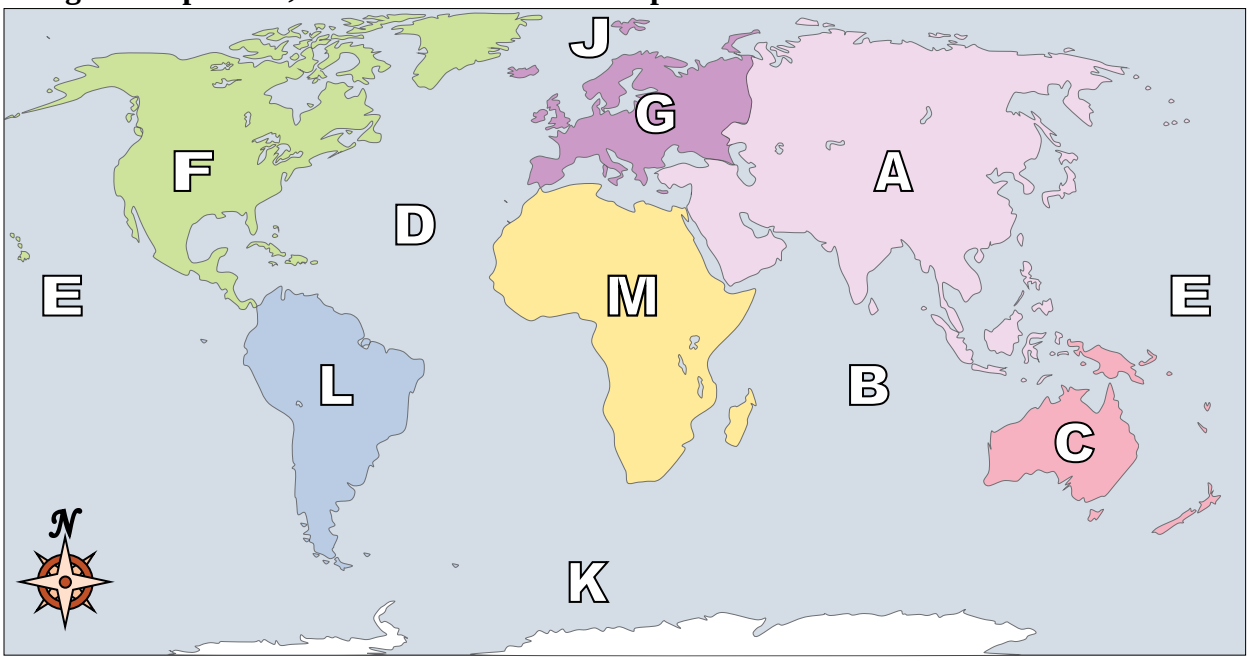

1) Atlantic Ocean D

2) Antarctica H

3) Australia C

4) Southern Ocean K

5) Asia A

6) Europe G

7) South America L

8) Indian Ocean B

9) Pacific Ocean E

10) Arctic Ocean J

11) Africa M

12) North America F

13) Which ocean touches South America's western border?
A. Pacific Ocean B. Arctic Ocean C. Indian Ocean D. Atlantic Ocean

14) Which of these continents is closest to Europe?
A. Africa B. South America C. Australia D. Antarctica

15) Which ocean touches Africa's eastern border?
A. Arctic Ocean B. Indian Ocean C. Atlantic Ocean D. Pacific Ocean

16) Which of these oceans is not touching North America?
A. Indian Ocean B. Atlantic Ocean C. Pacific Ocean D. Arctic Ocean

17) If you were in Africa and went south which continent would you end up in?
A. North America B. Antarctica C. Australia D. South America

Answers

1. D
2. H
3. C
4. K
5. A
6. G
7. L
8. B
9. E
10. J
11. M
12. F
13. A
14. A
15. B
16. A
17. B

1-10	94	88	82	76	71	65	59	53	47	41
11-17	35	29	24	18	12	6	0			

World Geography - Continents Name:

Using the map below, determine which letter represents each continent or ocean.

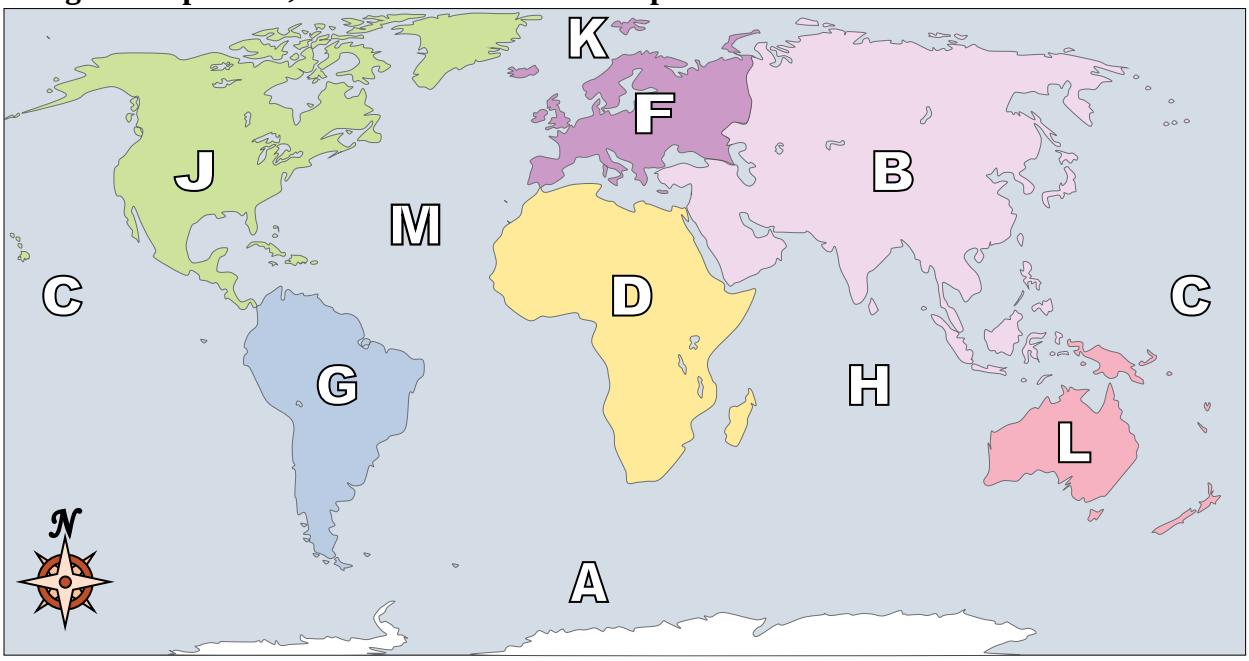

1) Atlantic Ocean _____

2) North America _____

3) Pacific Ocean _____

4) Europe _____

5) Africa _____

6) Australia _____

7) Asia _____

8) South America _____

9) Southern Ocean _____

10) Arctic Ocean _____

11) Indian Ocean _____

12) Antarctica _____

13) If you were in Europe and went south which continent would you end up in?
A. Asia B. Africa C. North America D. South America

14) Which of these continents is closest to Africa?
A. Antarctica B. South America C. Europe D. Australia

15) Which continent is touching Asia's western border?
A. Australia B. North America C. Africa D. Antarctica

16) If you were in South America and flew east to Australia which continent would you fly over?
A. Africa B. Europe C. Antarctica D. North America

17) Which continent is furthest south?
A. Australia B. Europe C. Antarctica D. Asia

Answers

1. _____
2. _____
3. _____
4. _____
5. _____
6. _____
7. _____
8. _____
9. _____
10. _____
11. _____
12. _____
13. _____
14. _____
15. _____
16. _____
17. _____

1-10	94	88	82	76	71	65	59	53	47	41
11-17	35	29	24	18	12	6	0			

World Geography - Continents

Name: **Answer Key**

Using the map below, determine which letter represents each continent or ocean.

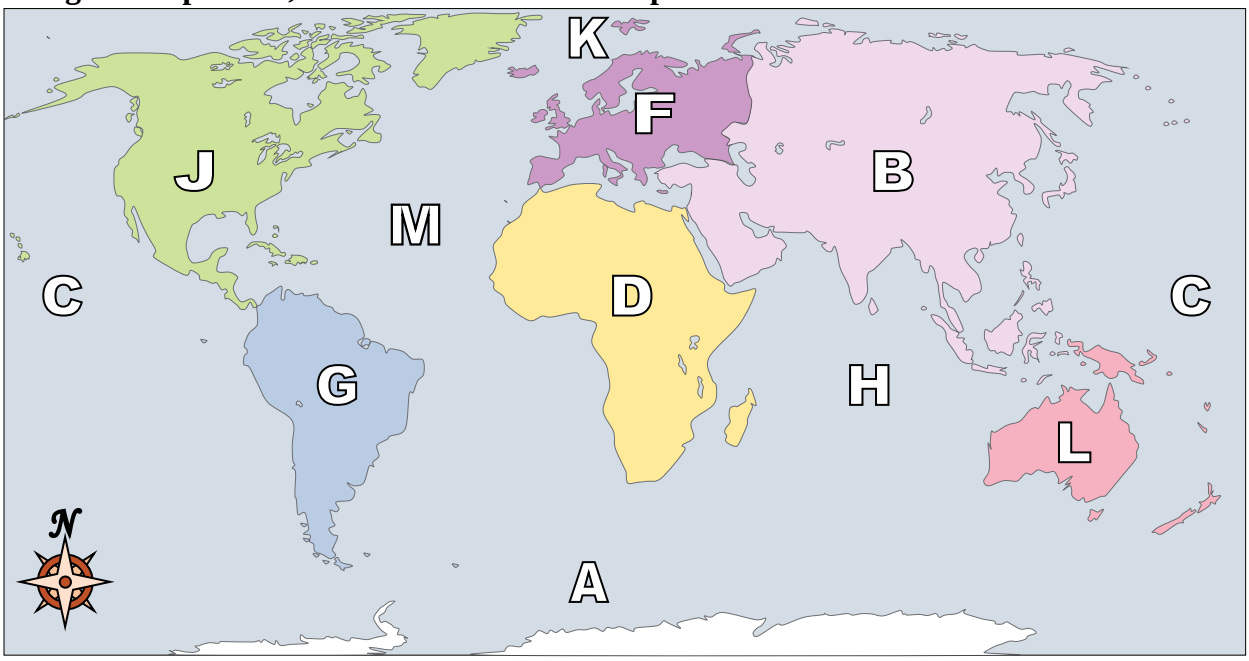

1) Atlantic Ocean M

2) North America J

3) Pacific Ocean C

4) Europe F

5) Africa D

6) Australia L

7) Asia B

8) South America G

9) Southern Ocean A

10) Arctic Ocean K

11) Indian Ocean H

12) Antarctica E

13) If you were in Europe and went south which continent would you end up in?
A. Asia B. Africa C. North America D. South America

14) Which of these continents is closest to Africa?
A. Antarctica B. South America C. Europe D. Australia

15) Which continent is touching Asia's western border?
A. Australia B. North America C. Africa D. Antarctica

16) If you were in South America and flew east to Australia which continent would you fly over?
A. Africa B. Europe C. Antarctica D. North America

17) Which continent is furthest south?
A. Australia B. Europe C. Antarctica D. Asia

Answers

1. M
2. J
3. C
4. F
5. D
6. L
7. B
8. G
9. A
10. K
11. H
12. E
13. B
14. C
15. C
16. A
17. C

1-10	94	88	82	76	71	65	59	53	47	41
11-17	35	29	24	18	12	6	0			

World Geography - Continents Name:

Using the map below, determine which letter represents each continent or ocean.

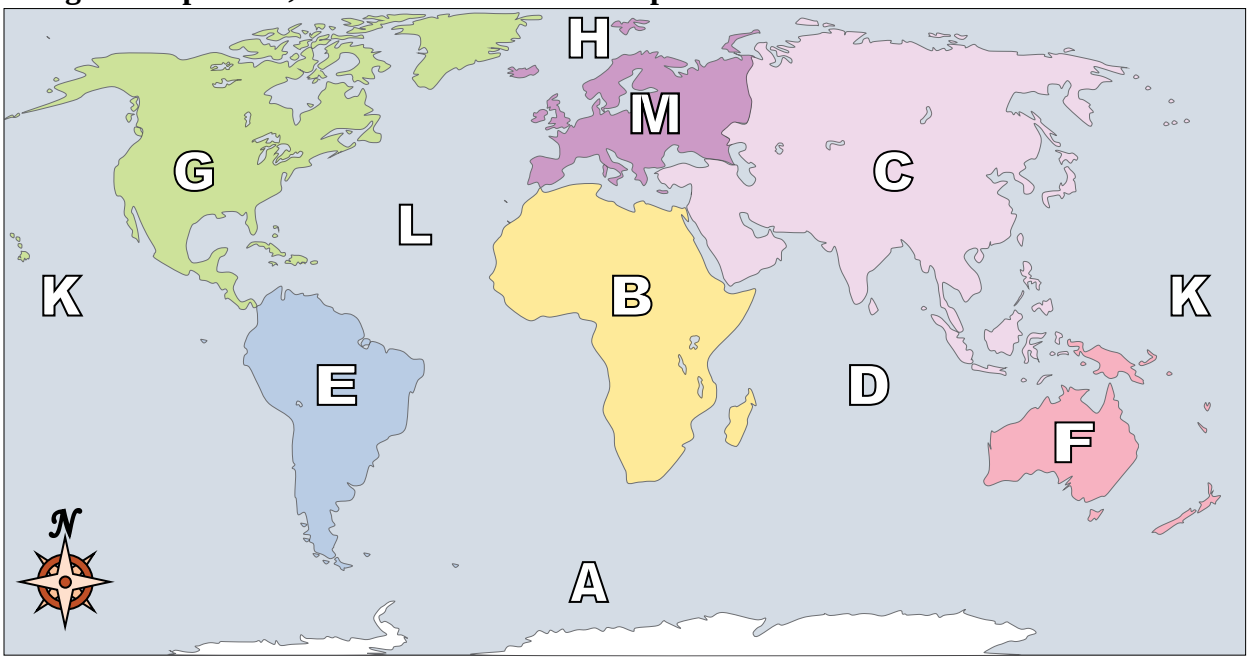

1) Asia _____

2) Europe _____

3) South America _____

4) Arctic Ocean _____

5) Pacific Ocean _____

6) Australia _____

7) Africa _____

8) North America _____

9) Southern Ocean _____

10) Indian Ocean _____

11) Atlantic Ocean _____

12) Antarctica _____

13) If you were in North America and went west which continent would you end up in?
A. Africa B. South America C. Australia D. Asia

14) Which continent is touching Asia's western border?
A. Australia B. South America C. Europe D. North America

15) Which continent is touching the eastern border of Europe?
A. Australia B. Africa C. Asia D. North America

16) Which ocean touches South America's eastern border?
A. Atlantic Ocean B. Arctic Ocean C. Pacific Ocean D. Indian Ocean

17) If you were in Europe and went east which continent would you end up in?
A. Australia B. Antarctica C. South America D. Asia

Answers

1. _____
2. _____
3. _____
4. _____
5. _____
6. _____
7. _____
8. _____
9. _____
10. _____
11. _____
12. _____
13. _____
14. _____
15. _____
16. _____
17. _____

1-10	94	88	82	76	71	65	59	53	47	41
11-17	35	29	24	18	12	6	0			

World Geography - Continents

Name: **Answer Key**

Using the map below, determine which letter represents each continent or ocean.

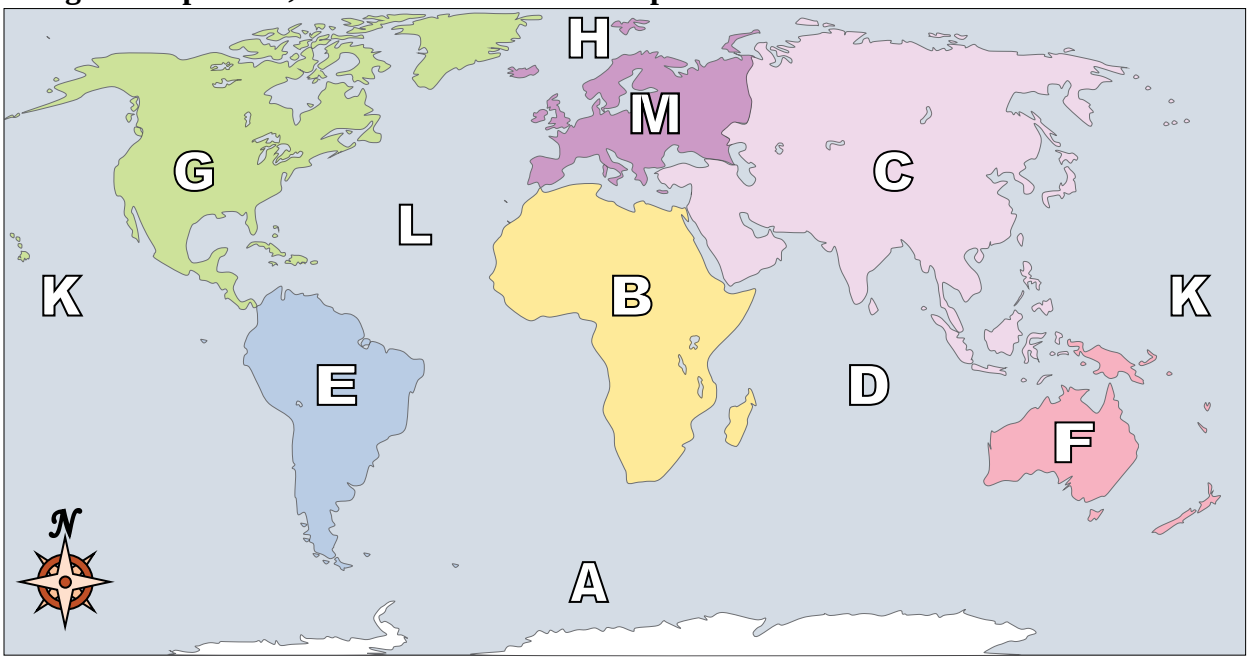

1) Asia C

2) Europe M

3) South America E

4) Arctic Ocean H

5) Pacific Ocean K

6) Australia F

7) Africa B

8) North America G

9) Southern Ocean A

10) Indian Ocean D

11) Atlantic Ocean L

12) Antarctica J

13) If you were in North America and went west which continent would you end up in?
A. Africa B. South America C. Australia D. Asia

14) Which continent is touching Asia's western border?
A. Australia B. South America C. Europe D. North America

15) Which continent is touching the eastern border of Europe?
A. Australia B. Africa C. Asia D. North America

16) Which ocean touches South America's eastern border?
A. Atlantic Ocean B. Arctic Ocean C. Pacific Ocean D. Indian Ocean

17) If you were in Europe and went east which continent would you end up in?
A. Australia B. Antarctica C. South America D. Asia

Answers

1. C
2. M
3. E
4. H
5. K
6. F
7. B
8. G
9. A
10. D
11. L
12. J
13. D
14. C
15. C
16. A
17. D

1-10	94	88	82	76	71	65	59	53	47	41
11-17	35	29	24	18	12	6	0			

World Geography - Continents Name:

Using the map below, determine which letter represents each continent or ocean.

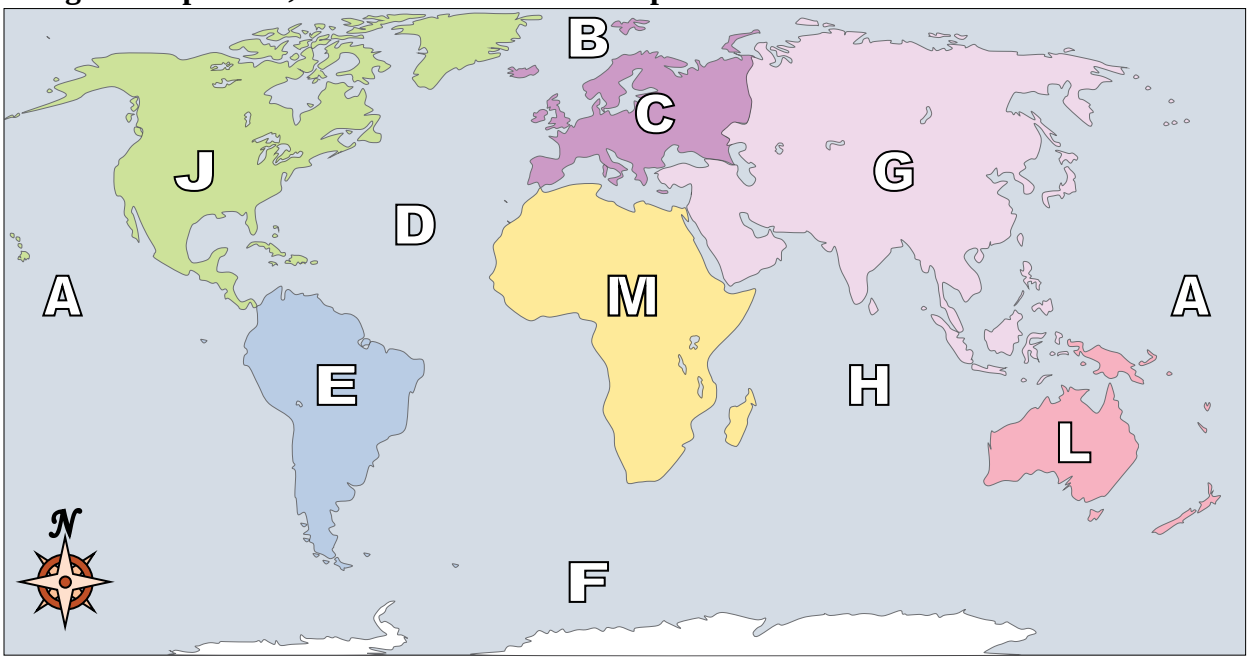

1) Africa _____

2) Australia _____

3) Europe _____

4) South America _____

5) Southern Ocean _____

6) Antarctica _____

7) Indian Ocean _____

8) Arctic Ocean _____

9) Asia _____

10) Atlantic Ocean _____

11) Pacific Ocean _____

12) North America _____

13) If you were in Africa and went south which continent would you end up in?
A. Australia B. South America C. Antarctica D. North America

14) If you were in Europe and went east which continent would you end up in?
A. North America B. Africa C. Asia D. Antarctica

15) Which of these continents is closest to Africa?
A. Australia B. North America C. Europe D. South America

16) Which ocean touches Africa's eastern border?
A. Arctic Ocean B. Atlantic Ocean C. Pacific Ocean D. Indian Ocean

17) If you were in Europe and went south which continent would you end up in?
A. South America B. North America C. Africa D. Asia

Answers

1. _____
2. _____
3. _____
4. _____
5. _____
6. _____
7. _____
8. _____
9. _____
10. _____
11. _____
12. _____
13. _____
14. _____
15. _____
16. _____
17. _____

1-10	94	88	82	76	71	65	59	53	47	41
11-17	35	29	24	18	12	6	0			

World Geography - Continents

Name: **Answer Key**

Using the map below, determine which letter represents each continent or ocean.

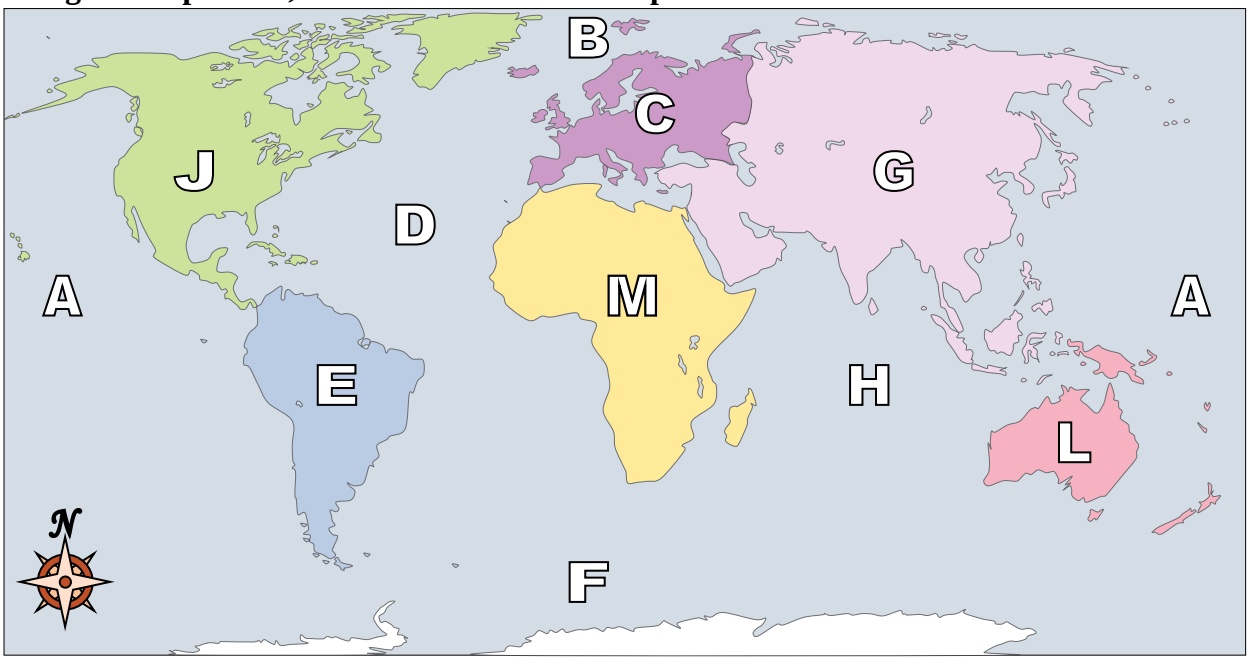

1) Africa M

2) Australia L

3) Europe C

4) South America E

5) Southern Ocean F

6) Antarctica K

7) Indian Ocean H

8) Arctic Ocean B

9) Asia G

10) Atlantic Ocean D

11) Pacific Ocean A

12) North America J

13) If you were in Africa and went south which continent would you end up in?
A. Australia B. South America C. Antarctica D. North America

14) If you were in Europe and went east which continent would you end up in?
A. North America B. Africa C. Asia D. Antarctica

15) Which of these continents is closest to Africa?
A. Australia B. North America C. Europe D. South America

16) Which ocean touches Africa's eastern border?
A. Arctic Ocean B. Atlantic Ocean C. Pacific Ocean D. Indian Ocean

17) If you were in Europe and went south which continent would you end up in?
A. South America B. North America C. Africa D. Asia

Answers

1. M
2. L
3. C
4. E
5. F
6. K
7. H
8. B
9. G
10. D
11. A
12. J
13. C
14. C
15. C
16. D
17. C

1-10	94	88	82	76	71	65	59	53	47	41
11-17	35	29	24	18	12	6	0			

World Geography - Continents Name:

Using the map below, determine which letter represents each continent or ocean.

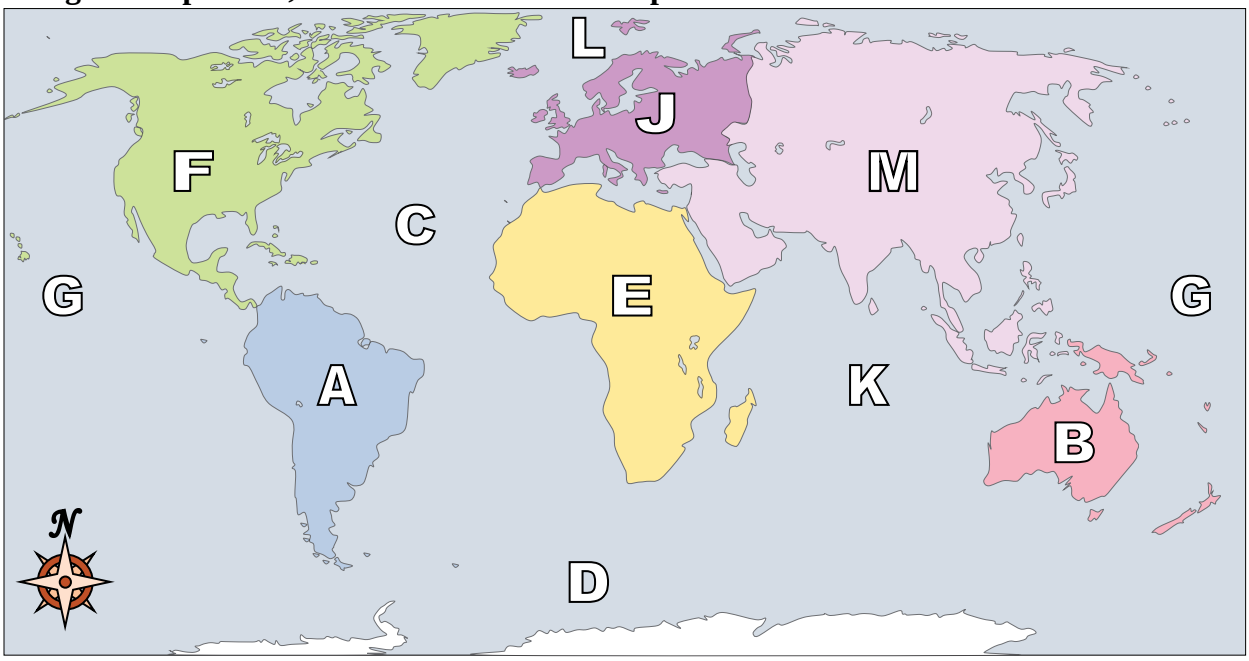

1) Indian Ocean _____

2) Africa _____

3) South America _____

4) Asia _____

5) Southern Ocean _____

6) Europe _____

7) Arctic Ocean _____

8) Australia _____

9) Atlantic Ocean _____

10) Pacific Ocean _____

11) Antarctica _____

12) North America _____

13) If you were in Africa and went south which continent would you end up in?
A. North America B. Australia C. South America D. Antarctica

14) Which ocean touches Africa's eastern border?
A. Indian Ocean B. Atlantic Ocean C. Arctic Ocean D. Pacific Ocean

15) Which continent is touching Asia's western border?
A. South America B. Africa C. North America D. Australia

16) Which ocean touches South America's western border?
A. Pacific Ocean B. Indian Ocean C. Arctic Ocean D. Atlantic Ocean

17) If you were in South America and flew east to Australia which continent would you fly over?
A. Africa B. Asia C. Europe D. North America

Answers

1. _____
2. _____
3. _____
4. _____
5. _____
6. _____
7. _____
8. _____
9. _____
10. _____
11. _____
12. _____
13. _____
14. _____
15. _____
16. _____
17. _____

1-10	94	88	82	76	71	65	59	53	47	41
11-17	35	29	24	18	12	6	0			

World Geography - Continents

Name: **Answer Key**

Using the map below, determine which letter represents each continent or ocean.

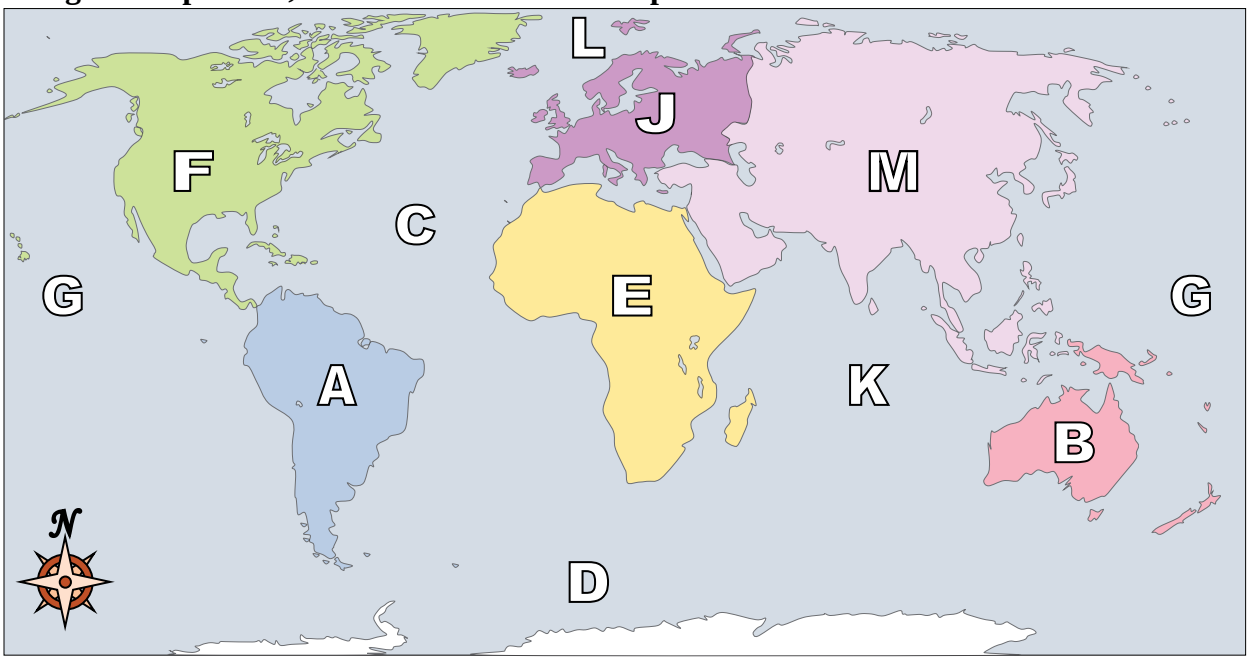

1) Indian Ocean K

2) Africa E

3) South America A

4) Asia M

5) Southern Ocean D

6) Europe J

7) Arctic Ocean L

8) Australia B

9) Atlantic Ocean C

10) Pacific Ocean G

11) Antarctica H

12) North America F

13) If you were in Africa and went south which continent would you end up in?
A. North America B. Australia C. South America D. Antarctica

14) Which ocean touches Africa's eastern border?
A. Indian Ocean B. Atlantic Ocean C. Arctic Ocean D. Pacific Ocean

15) Which continent is touching Asia's western border?
A. South America B. Africa C. North America D. Australia

16) Which ocean touches South America's western border?
A. Pacific Ocean B. Indian Ocean C. Arctic Ocean D. Atlantic Ocean

17) If you were in South America and flew east to Australia which continent would you fly over?
A. Africa B. Asia C. Europe D. North America

Answers

1. K
2. E
3. A
4. M
5. D
6. J
7. L
8. B
9. C
10. G
11. H
12. F
13. D
14. A
15. B
16. A
17. A

1-10	94	88	82	76	71	65	59	53	47	41
11-17	35	29	24	18	12	6	0			

World Geography - Continents Name:

Using the map below, determine which letter represents each continent or ocean.

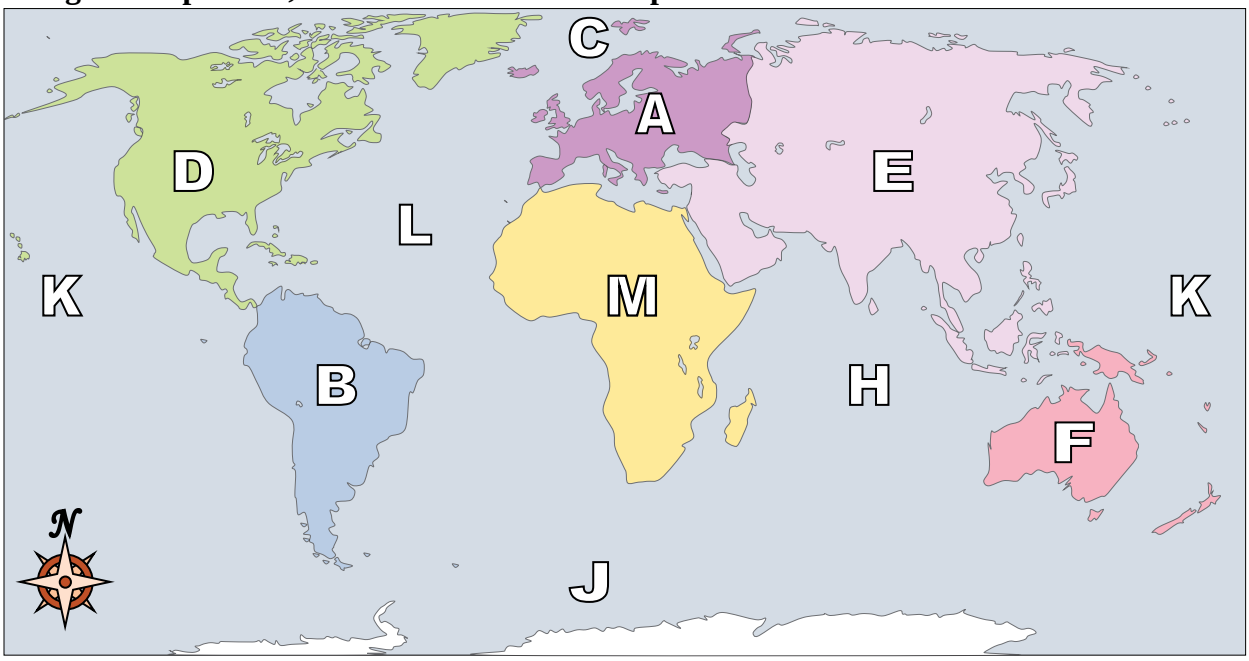

1) Southern Ocean _____

2) South America _____

3) Africa _____

4) Indian Ocean _____

5) Australia _____

6) Asia _____

7) Pacific Ocean _____

8) Atlantic Ocean _____

9) Antarctica _____

10) Arctic Ocean _____

11) North America _____

12) Europe _____

13) Which ocean touches South America's western border?
A. Pacific Ocean B. Atlantic Ocean C. Indian Ocean D. Arctic Ocean

14) Which continent is touching Asia's western border?
A. Antarctica B. Africa C. South America D. North America

15) Which ocean touches South America's eastern border?
A. Pacific Ocean B. Indian Ocean C. Arctic Ocean D. Atlantic Ocean

16) Which continent is not touching any other continents?
A. Asia B. Africa C. South America D. Australia

17) Which of these continents is closest to Africa?
A. North America B. South America C. Australia D. Asia

Answers

1. _____
2. _____
3. _____
4. _____
5. _____
6. _____
7. _____
8. _____
9. _____
10. _____
11. _____
12. _____
13. _____
14. _____
15. _____
16. _____
17. _____

1-10	94	88	82	76	71	65	59	53	47	41
11-17	35	29	24	18	12	6	0			

World Geography - Continents

Name: **Answer Key**

Using the map below, determine which letter represents each continent or ocean.

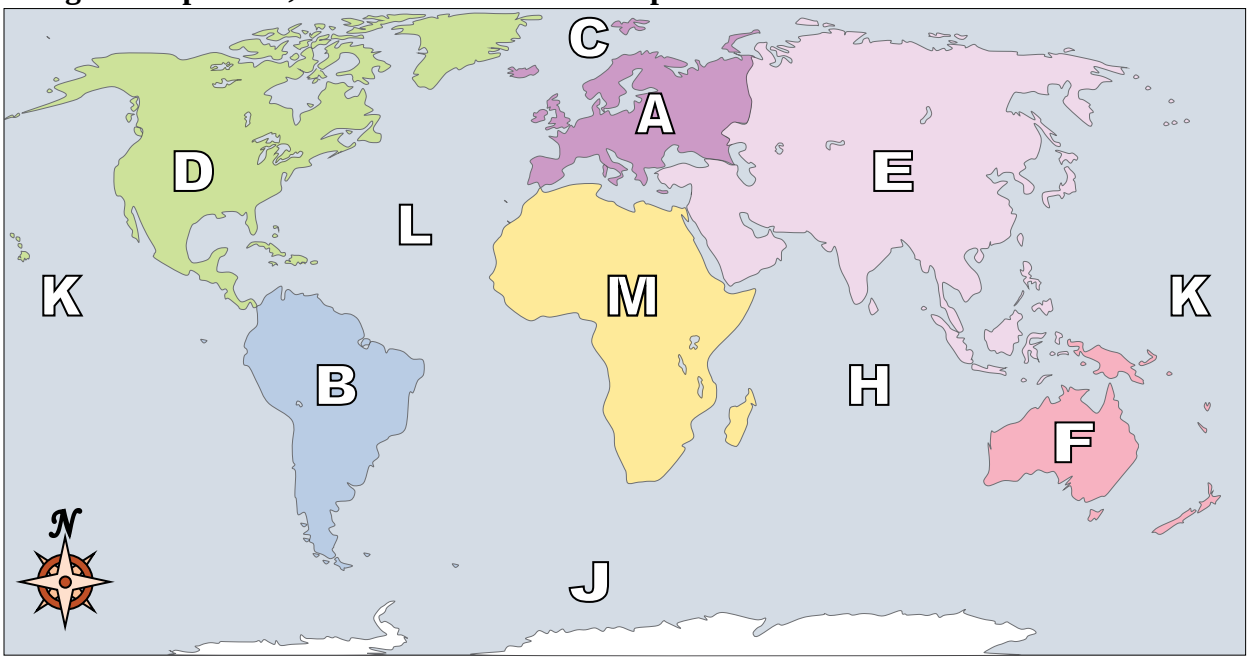

1) Southern Ocean J

2) South America B

3) Africa M

4) Indian Ocean H

5) Australia F

6) Asia E

7) Pacific Ocean K

8) Atlantic Ocean L

9) Antarctica G

10) Arctic Ocean C

11) North America D

12) Europe A

13) Which ocean touches South America's western border?
A. Pacific Ocean B. Atlantic Ocean C. Indian Ocean D. Arctic Ocean

14) Which continent is touching Asia's western border?
A. Antarctica B. Africa C. South America D. North America

15) Which ocean touches South America's eastern border?
A. Pacific Ocean B. Indian Ocean C. Arctic Ocean D. Atlantic Ocean

16) Which continent is not touching any other continents?
A. Asia B. Africa C. South America D. Australia

17) Which of these continents is closest to Africa?
A. North America B. South America C. Australia D. Asia

Answers

1. J
2. B
3. M
4. H
5. F
6. E
7. K
8. L
9. G
10. C
11. D
12. A
13. A
14. B
15. D
16. D
17. D

1-10	94	88	82	76	71	65	59	53	47	41
11-17	35	29	24	18	12	6	0			

World Geography - Continents Name:

Using the map below, determine which letter represents each continent or ocean.

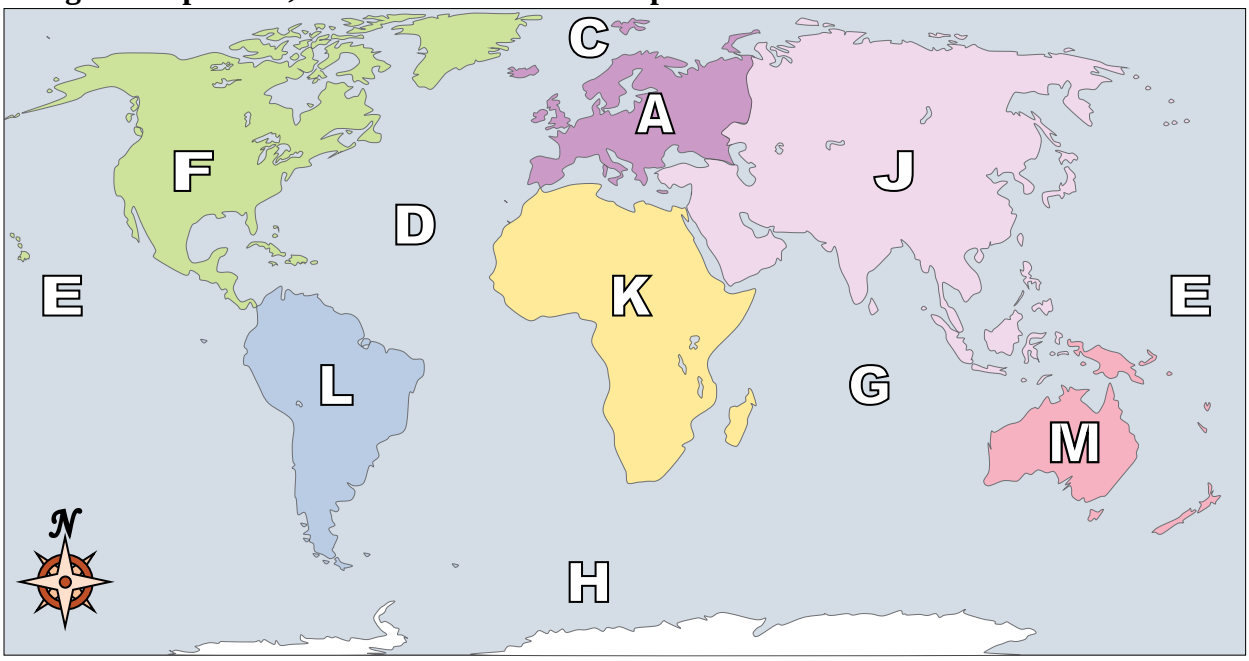

1) Australia _____

2) Pacific Ocean _____

3) Southern Ocean _____

4) North America _____

5) Asia _____

6) Antarctica _____

7) Atlantic Ocean _____

8) Indian Ocean _____

9) Europe _____

10) Arctic Ocean _____

11) South America _____

12) Africa _____

13) Which ocean touches Africa's eastern border?
A. Pacific Ocean B. Atlantic Ocean C. Indian Ocean D. Arctic Ocean

14) Which ocean touches South America's western border?
A. Pacific Ocean B. Indian Ocean C. Atlantic Ocean D. Arctic Ocean

15) Which ocean touches Africa's western border?
A. Atlantic Ocean B. Pacific Ocean C. Arctic Ocean D. Indian Ocean

16) If you were in South America and flew east to Australia which continent would you fly over?
A. Asia B. Europe C. Antarctica D. Africa

17) Which continent is not touching any other continents?
A. Asia B. Africa C. Antarctica D. Europe

Answers

1. _____
2. _____
3. _____
4. _____
5. _____
6. _____
7. _____
8. _____
9. _____
10. _____
11. _____
12. _____
13. _____
14. _____
15. _____
16. _____
17. _____

1-10	94	88	82	76	71	65	59	53	47	41
11-17	35	29	24	18	12	6	0			

World Geography - Continents

Name: **Answer Key**

Using the map below, determine which letter represents each continent or ocean.

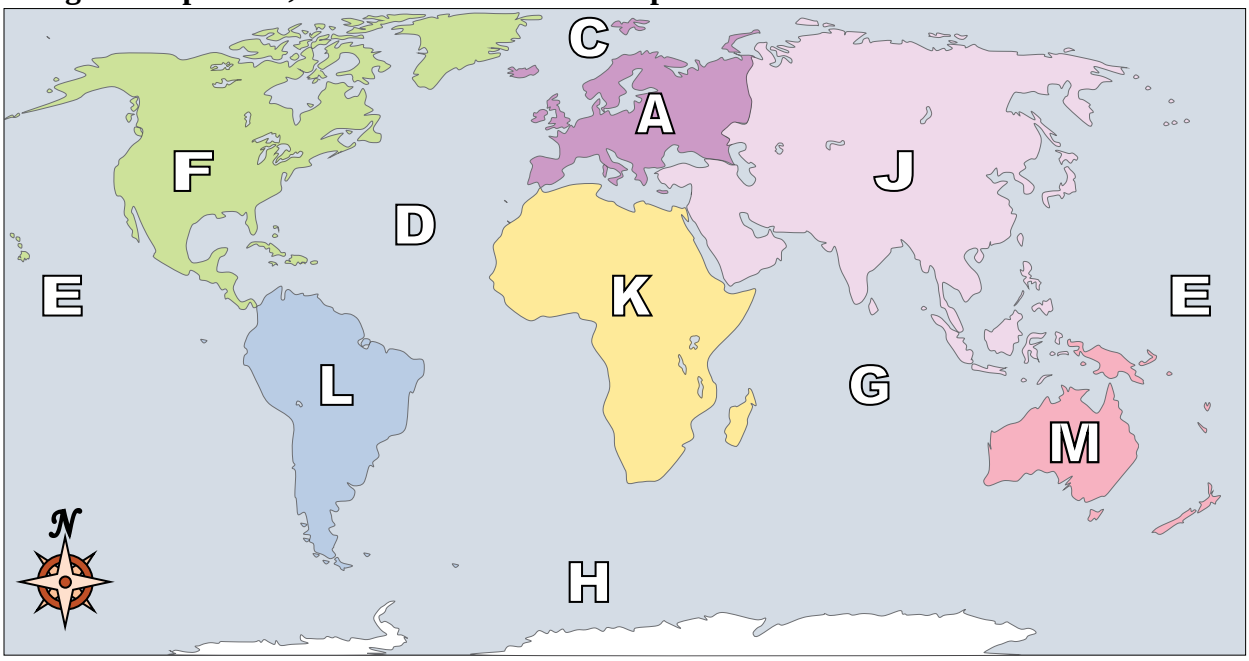

1) Australia M

2) Pacific Ocean E

3) Southern Ocean H

4) North America F

5) Asia J

6) Antarctica B

7) Atlantic Ocean D

8) Indian Ocean G

9) Europe A

10) Arctic Ocean C

11) South America L

12) Africa K

13) Which ocean touches Africa's eastern border?
A. Pacific Ocean B. Atlantic Ocean C. Indian Ocean D. Arctic Ocean

14) Which ocean touches South America's western border?
A. Pacific Ocean B. Indian Ocean C. Atlantic Ocean D. Arctic Ocean

15) Which ocean touches Africa's western border?
A. Atlantic Ocean B. Pacific Ocean C. Arctic Ocean D. Indian Ocean

16) If you were in South America and flew east to Australia which continent would you fly over?
A. Asia B. Europe C. Antarctica D. Africa

17) Which continent is not touching any other continents?
A. Asia B. Africa C. Antarctica D. Europe

Answers

1. M
2. E
3. H
4. F
5. J
6. B
7. D
8. G
9. A
10. C
11. L
12. K
13. C
14. A
15. A
16. D
17. C

1-10	94	88	82	76	71	65	59	53	47	41
11-17	35	29	24	18	12	6	0			