Identifying Smaller Units

Name:

Determine the number of smaller fractional pieces that can be made from the larger piece.

Ex) $8\frac{2}{3}$

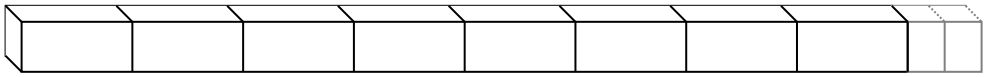

1) $7\frac{2}{3}$

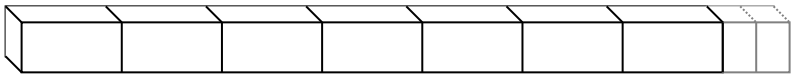

2) $5\frac{1}{3}$



3) $2\frac{1}{3}$

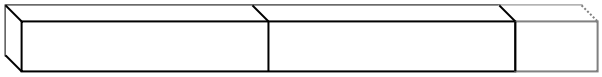

4) $1\frac{3}{4}$



5) $2\frac{2}{5}$



6) $7\frac{1}{2}$

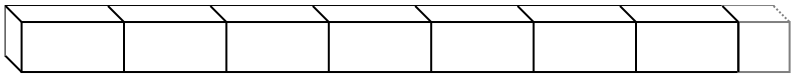

7) $9\frac{1}{4}$

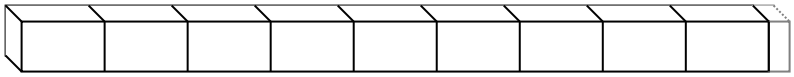

8) $1\frac{1}{2}$



9) $5\frac{2}{3}$

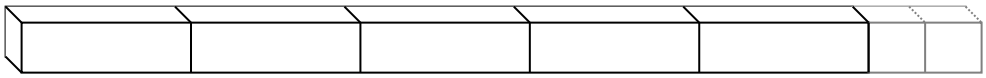

10) $2\frac{1}{3}$

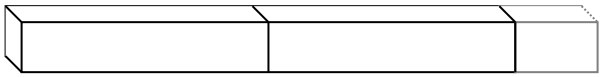

Answers

Ex. 26

1. _____
2. _____
3. _____
4. _____
5. _____
6. _____
7. _____
8. _____
9. _____
10. _____

1-10	90	80	70	60	50	40	30	20	10	0

Identifying Smaller Units

Name: **Answer Key**

Determine the number of smaller fractional pieces that can be made from the larger piece.

Ex) $8\frac{2}{3}$

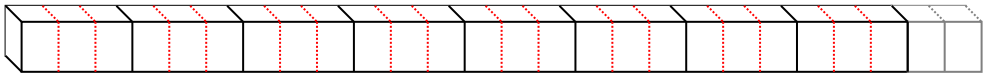

1) $7\frac{2}{3}$

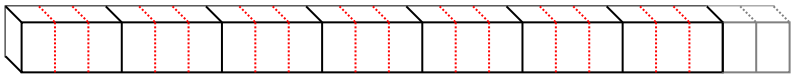

2) $5\frac{1}{3}$

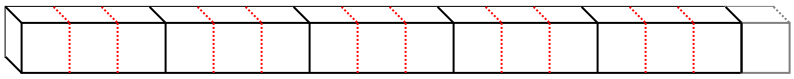

3) $2\frac{1}{3}$

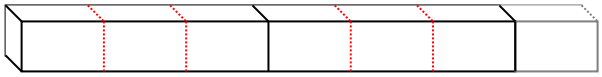

4) $1\frac{3}{4}$



5) $2\frac{2}{5}$

6) $7\frac{1}{2}$

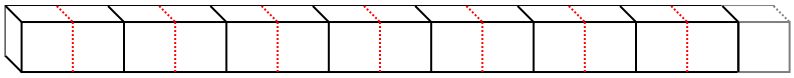

7) $9\frac{1}{4}$

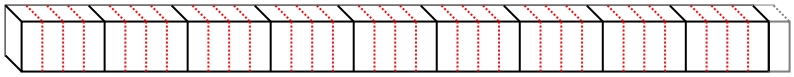

8) $1\frac{1}{2}$



9) $5\frac{2}{3}$

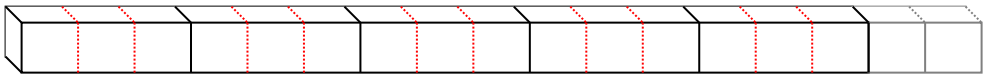

10) $2\frac{1}{3}$

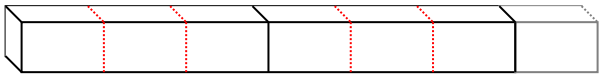

Answers

Ex.	26
1.	23
2.	16
3.	7
4.	7
5.	12
6.	15
7.	37
8.	3
9.	17
10.	7

1-10	90	80	70	60	50	40	30	20	10	0