Finding Volume with Unit Cubes

Name:

Find the length, width and height of the rectangular prism. Then find the volume.

Ex)

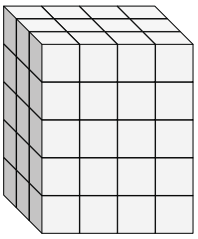

1)

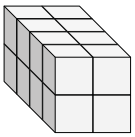

2)

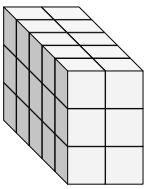

3)

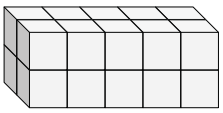

4)

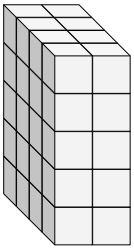

5)

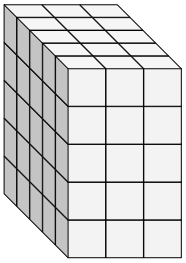

6)

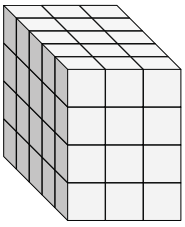

7)

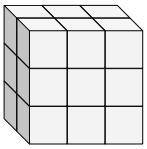

8)

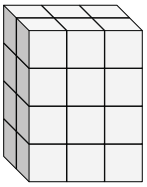

9)

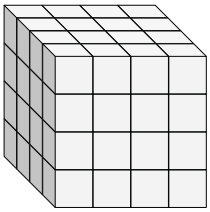

10)

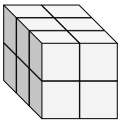

11)

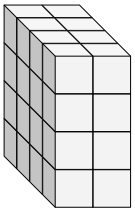

Answers

	L	W	H	V
Ex.	3	4	5	60
1.				
2.				
3.				
4.				
5.				
6.				
7.				
8.				
9.				
10.				
11.				

1-10	91	82	73	64	55	45	36	27	18	9
11	0									

Finding Volume with Unit Cubes

Name: **Answer Key**

Find the length, width and height of the rectangular prism. Then find the volume.

Ex)

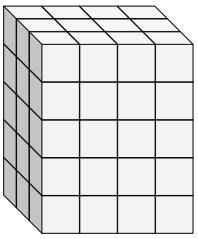

1)

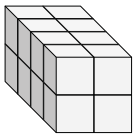

2)

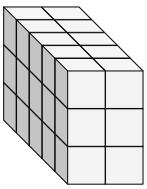

3)

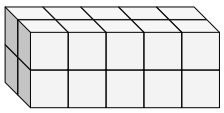

4)

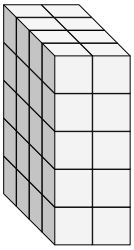

5)

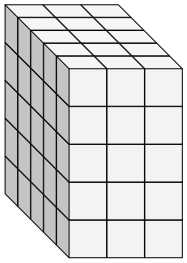

6)

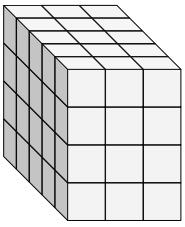

7)

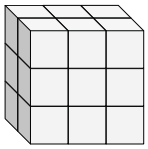

8)

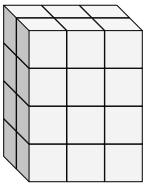

9)

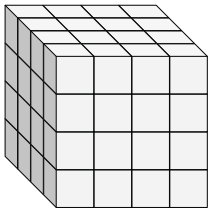

10)

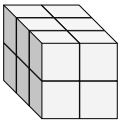

11)

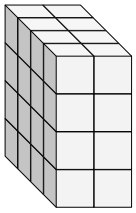

Answers

	L	W	H	V
Ex.	3	4	5	60
1.	4	2	2	16
2.	5	2	3	30
3.	2	5	2	20
4.	4	2	5	40
5.	5	3	5	75
6.	5	3	4	60
7.	2	3	3	18
8.	2	3	4	24
9.	4	4	4	64
10.	3	2	2	12
11.	4	2	4	32

1-10	91	82	73	64	55	45	36	27	18	9
11	0									