Visual Place Value (Less than 20)

Name:

Fill in the blanks to find the amounts.

Ex)

0 4

tens ones

1)

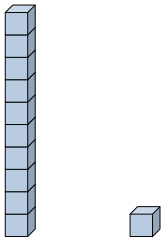

tens ones

2)

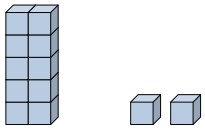

tens ones

3)

tens ones

4)

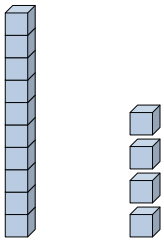

tens ones

5)

tens ones

6)

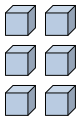

tens ones

7)

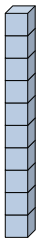

tens ones

8)

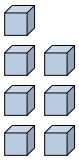

tens ones

9)

tens ones

10)

tens ones

11)

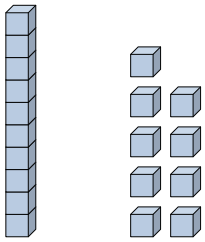

tens ones

Answers

Ex. 4

1. _____
2. _____
3. _____
4. _____
5. _____
6. _____
7. _____
8. _____
9. _____
10. _____
11. _____

Visual Place Value (Less than 20) Name: **Answer Key**

Fill in the blanks to find the amounts.

Ex)

0 tens 4 ones

1)

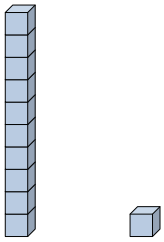

1 tens 1 ones

2)

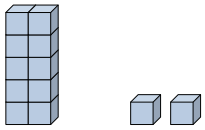

1 tens 2 ones

3)

0 tens 2 ones

4)

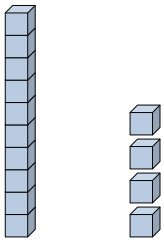

1 tens 4 ones

5)

0 tens 1 ones

6)

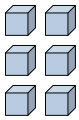

0 tens 6 ones

7)

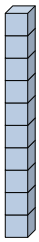

1 tens 0 ones

8)

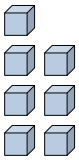

0 tens 7 ones

9)

0 tens 9 ones

10)

0 tens 3 ones

11)

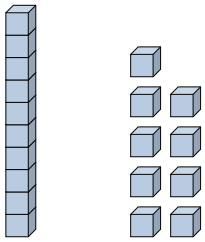

1 tens 9 ones

Answers

Ex. 4

1. 11
2. 12
3. 2
4. 14
5. 1
6. 6
7. 10
8. 7
9. 9
10. 3
11. 19