Determining Symmetry

Name:

**Determine if the line through each figure is a line of symmetry.**

**Ex)**

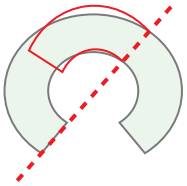

**1)**

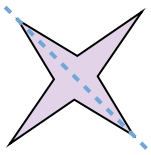

**2)**

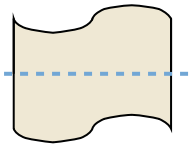

**3)**

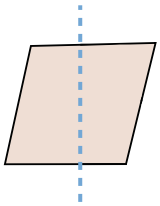

**4)**

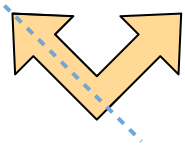

**5)**

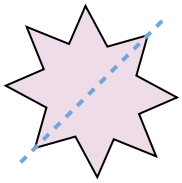

**6)**

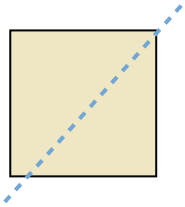

**7)**

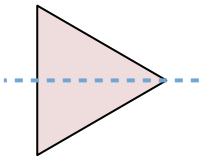

**8)**

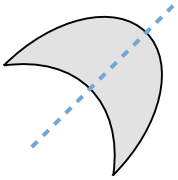

**9)**

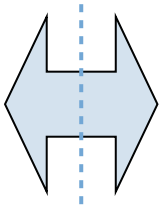

**10)**

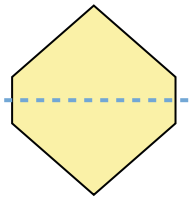

**11)**

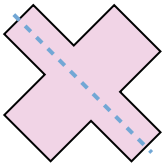

## Answers

Ex. no

1. _____
2. _____
3. _____
4. _____
5. _____
6. _____
7. _____
8. _____
9. _____
10. _____
11. _____



| | | | | | | | | | | |
|---|---|---|---|---|---|---|---|---|---|---|
| 1-10 | 91 | 82 | 73 | 64 | 55 | 45 | 36 | 27 | 18 | 9 |
| 11 | 0 | | | | | | | | | |

Determining Symmetry

Name: **Answer Key**

**Determine if the line through each figure is a line of symmetry.**

**Ex)**

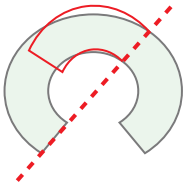

**1)**

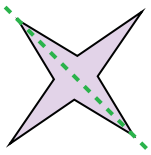

**2)**

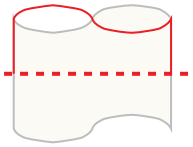

**3)**

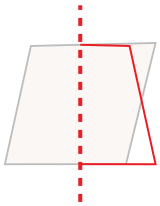

**4)**

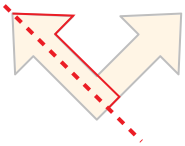

**5)**



**6)**

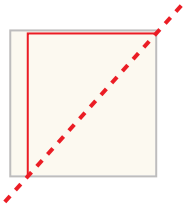

**7)**

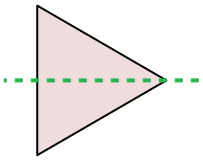

**8)**

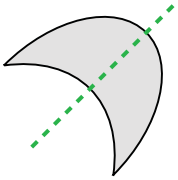

**9)**

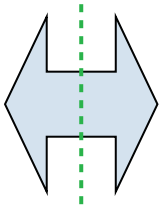

**10)**

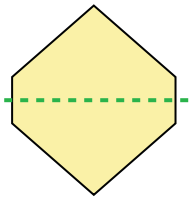

**11)**

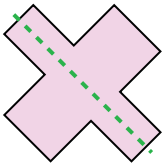

## Answers

| | |
|---|---|
| Ex. | no |
| 1. | yes |
| 2. | no |
| 3. | no |
| 4. | no |
| 5. | yes |
| 6. | no |
| 7. | yes |
| 8. | yes |
| 9. | yes |
| 10. | yes |
| 11. | yes |



| | | | | | | | | | | |
|---|---|---|---|---|---|---|---|---|---|---|
| 1-10 | 91 | 82 | 73 | 64 | 55 | 45 | 36 | 27 | 18 | 9 |
| 11 | 0 | | | | | | | | | |