Finding Ratios (visual)

Name:

Solve each problem.

Ex) What is the ratio of circles to moons?

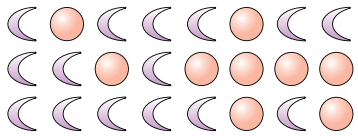

1) What is the ratio of hearts to moons?



2) What is the ratio of triangles to circles?

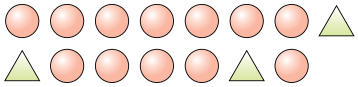

3) What is the ratio of triangles to circles?

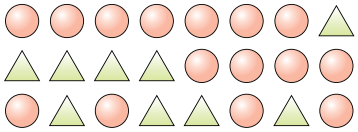

4) What is the ratio of triangles to moons?

5) What is the ratio of moons to triangles?

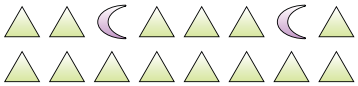

6) What is the ratio of squares to triangles?

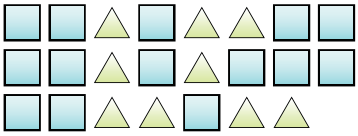

7) What is the ratio of hearts to moons?



8) What is the ratio of stars to moons?

9) What is the ratio of squares to circles?

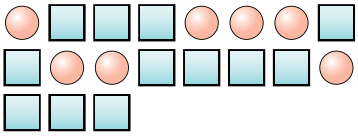

10) What is the ratio of circles to moons?

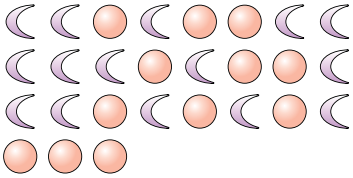

11) What is the ratio of squares to hearts?



Answers

Ex. 9:15

1. _____
2. _____
3. _____
4. _____
5. _____
6. _____
7. _____
8. _____
9. _____
10. _____
11. _____

1-10	91	82	73	64	55	45	36	27	18	9
11	0									

Finding Ratios (visual)

Name: **Answer Key**

Solve each problem.

Ex) What is the ratio of circles to moons?

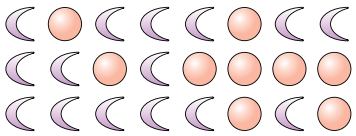

1) What is the ratio of hearts to moons?



2) What is the ratio of triangles to circles?

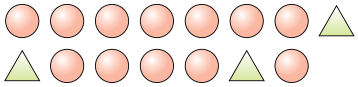

3) What is the ratio of triangles to circles?

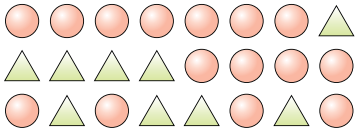

4) What is the ratio of triangles to moons?

5) What is the ratio of moons to triangles?

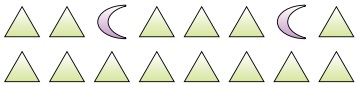

6) What is the ratio of squares to triangles?

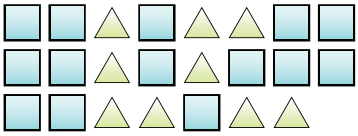

7) What is the ratio of hearts to moons?



8) What is the ratio of stars to moons?

9) What is the ratio of squares to circles?

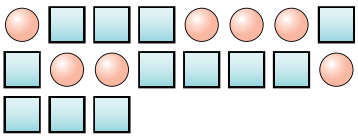

10) What is the ratio of circles to moons?

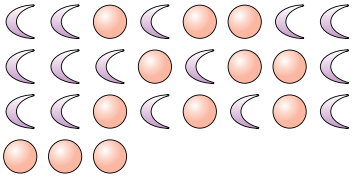

11) What is the ratio of squares to hearts?



Answers

Ex.	9:15
1.	15:7
2.	3:12
3.	9:15
4.	6:3
5.	2:14
6.	14:9
7.	14:13
8.	4:5
9.	12:7
10.	12:15
11.	13:11

1-10	91	82	73	64	55	45	36	27	18	9
11	0									