Rewriting Multiplication Problems (visual)

Name:

Write each array as a multipication problem and solve.

Ex)



1)

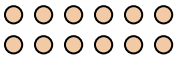

2)

3)



4)

5)

6)



7)

8)

9)



10)



11)



Answers

Ex. 8 × 7 = 56

1. _____
2. _____
3. _____
4. _____
5. _____
6. _____
7. _____
8. _____
9. _____
10. _____
11. _____

1-10	91	82	73	64	55	45	36	27	18	9
11	0									

Rewriting Multiplication Problems (visual) Name: **Answer Key**

Write each array as a multipication problem and solve.

Ex)



1)

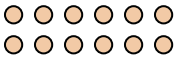

2)

3)



4)

5)

6)



7)

8)

9)



10)



11)



Answers

Ex. 8 × 7 = 56

1. 2 × 6 = 12
2. 7 × 3 = 21
3. 7 × 10 = 70
4. 9 × 5 = 45
5. 8 × 4 = 32
6. 6 × 7 = 42
7. 4 × 3 = 12
8. 7 × 4 = 28
9. 2 × 5 = 10
10. 5 × 2 = 10
11. 5 × 7 = 35

1-10	91	82	73	64	55	45	36	27	18	9
11	0									