Visual Division

Name:

Use the shapes provided to answer the questions.

Ex) How many groups of 6 can you make with the 18 shapes below?

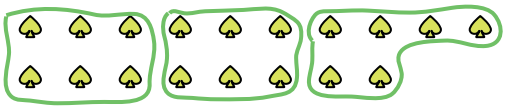

1) How many groups of 2 can you make with the 18 shapes below?

2) How many groups of 4 can you make with the 24 shapes below?



3) How many groups of 5 can you make with the 30 shapes below?



4) How many groups of 5 can you make with the 10 shapes below?

5) How many groups of 6 can you make with the 18 shapes below?

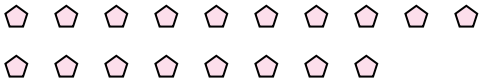

6) How many groups of 4 can you make with the 16 shapes below?

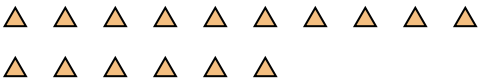

7) How many groups of 9 can you make with the 36 shapes below?



8) How many groups of 4 can you make with the 16 shapes below?

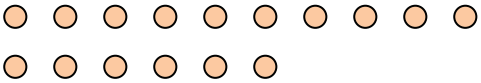

9) How many groups of 5 can you make with the 35 shapes below?

10) How many groups of 7 can you make with the 35 shapes below?

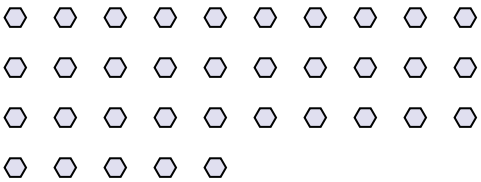

11) How many groups of 4 can you make with the 12 shapes below?

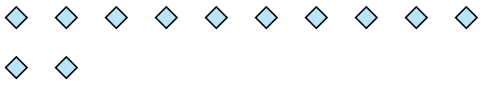

Answers

Ex. 3

1. _____
2. _____
3. _____
4. _____
5. _____
6. _____
7. _____
8. _____
9. _____
10. _____
11. _____

1-10	91	82	73	64	55	45	36	27	18	9
11	0									

Visual Division

Name: **Answer Key**

Use the shapes provided to answer the questions.

Ex) How many groups of 6 can you make with the 18 shapes below?

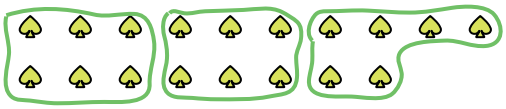

1) How many groups of 2 can you make with the 18 shapes below?

2) How many groups of 4 can you make with the 24 shapes below?



3) How many groups of 5 can you make with the 30 shapes below?



4) How many groups of 5 can you make with the 10 shapes below?

5) How many groups of 6 can you make with the 18 shapes below?

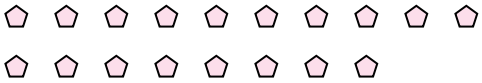

6) How many groups of 4 can you make with the 16 shapes below?

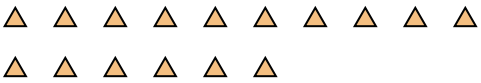

7) How many groups of 9 can you make with the 36 shapes below?



8) How many groups of 4 can you make with the 16 shapes below?

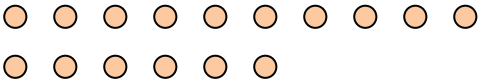

9) How many groups of 5 can you make with the 35 shapes below?

10) How many groups of 7 can you make with the 35 shapes below?

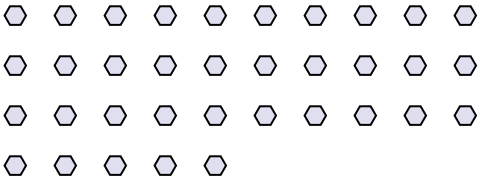

11) How many groups of 4 can you make with the 12 shapes below?

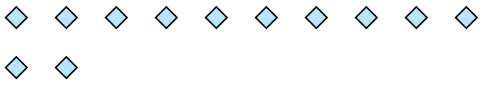

Answers

Ex.	3
1.	9
2.	6
3.	6
4.	2
5.	3
6.	4
7.	4
8.	4
9.	7
10.	5
11.	3

1-10	91	82	73	64	55	45	36	27	18	9
11	0									