Dividing with a Numberline

Name:

Use the numberline to solve each problem.

1) 27÷9=

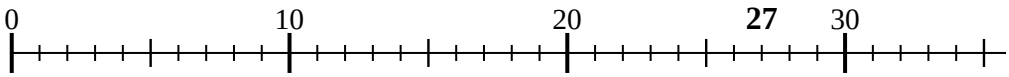

2) 28÷7=

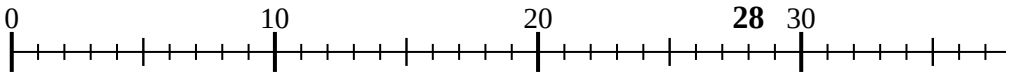

3) 6÷2=

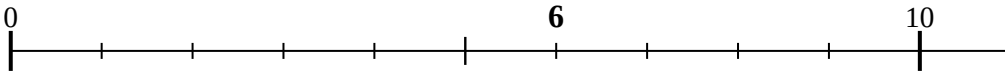

4) 15÷3=

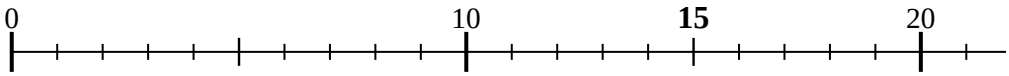

5) 24÷8=

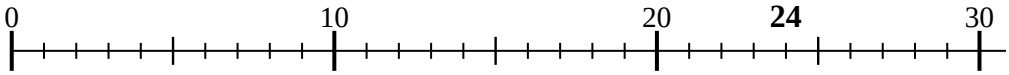

6) 16÷4=

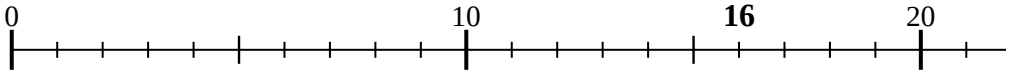

7) 6÷3=

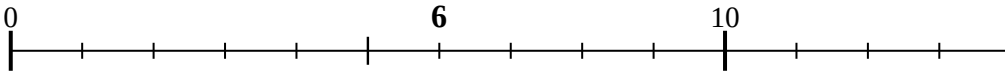

8) 40÷8=

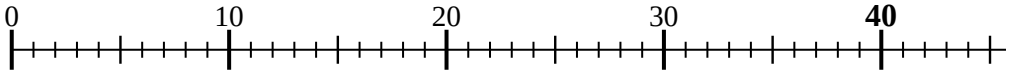

9) 8÷2=

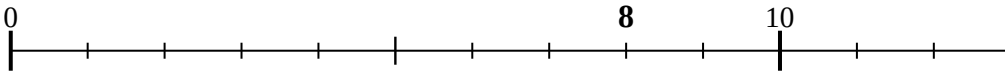

10) 10÷2=

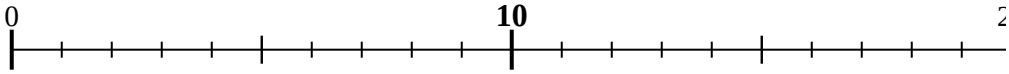

11) 9÷3=

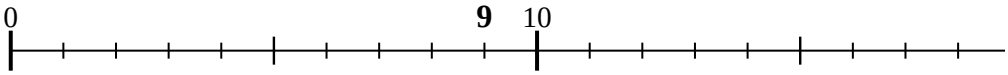

Answers

1. _____
2. _____
3. _____
4. _____
5. _____
6. _____
7. _____
8. _____
9. _____
10. _____
11. _____

1-10	91	82	73	64	55	45	36	27	18	9
11	0									

Dividing with a Numberline

Name: **Answer Key**

Use the numberline to solve each problem.

1) 27÷9=

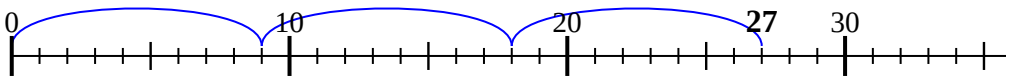

2) 28÷7=

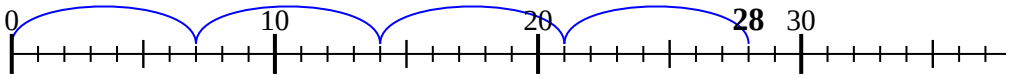

3) 6÷2=

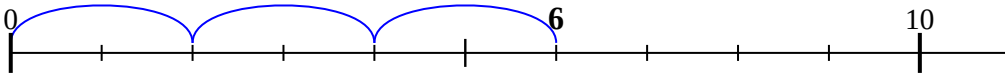

4) 15÷3=

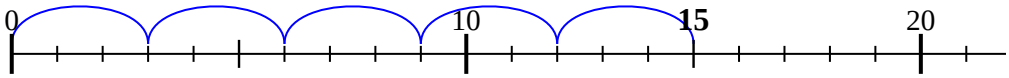

5) 24÷8=

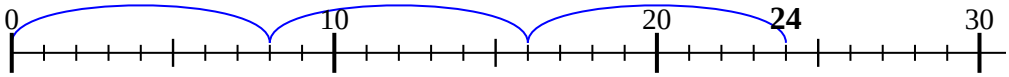

6) 16÷4=

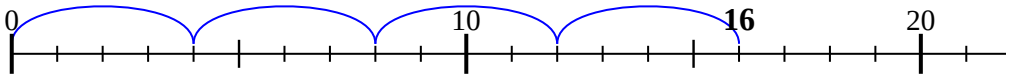

7) 6÷3=

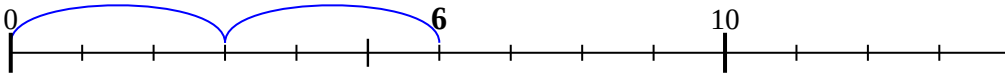

8) 40÷8=

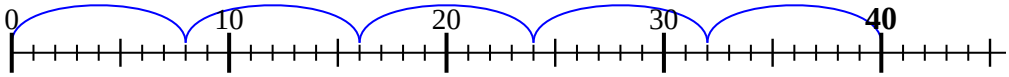

9) 8÷2=

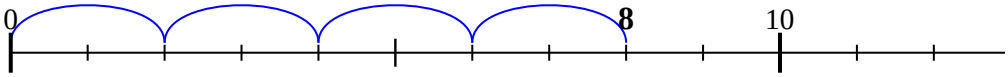

10) 10÷2=

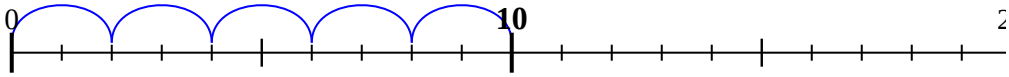

11) 9÷3=

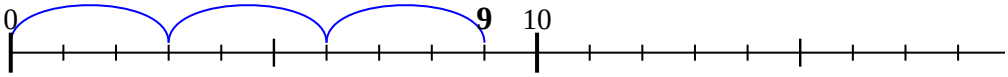

Answers

1. 3
2. 4
3. 3
4. 5
5. 3
6. 4
7. 2
8. 5
9. 4
10. 5
11. 3