Dividing with a Numberline

Name:

Use the numberline to solve each problem.

1) 50 ÷ 10 =

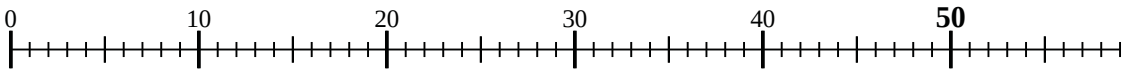

2) 20 ÷ 4 =

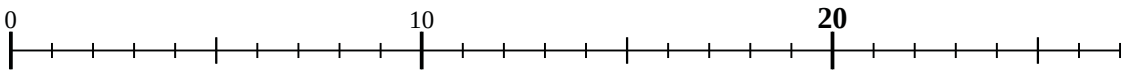

3) 18 ÷ 9 =

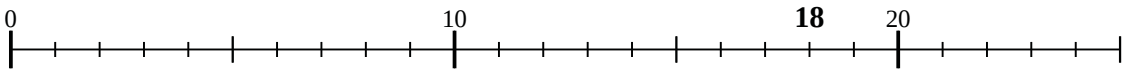

4) 15 ÷ 3 =

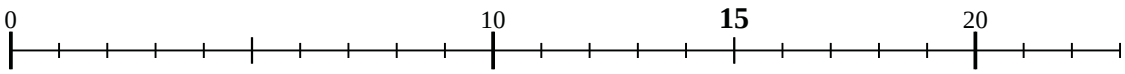

5) 28 ÷ 7 =

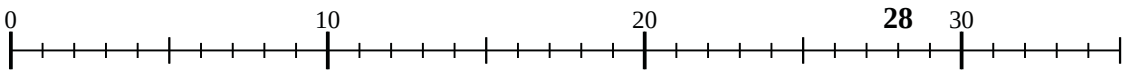

6) 21 ÷ 7 =

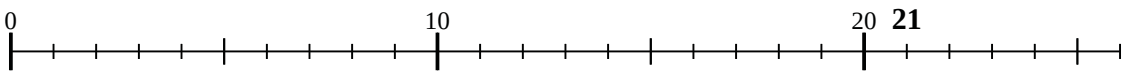

7) 25 ÷ 5 =

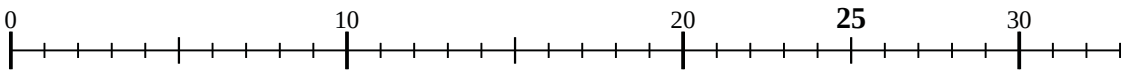

8) 16 ÷ 4 =

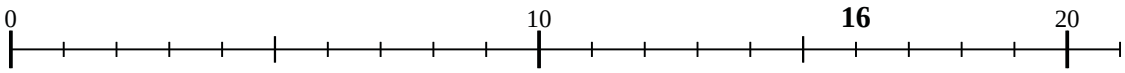

9) 6 ÷ 2 =

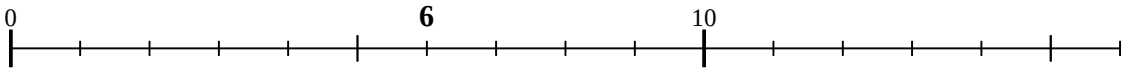

10) 27 ÷ 9 =

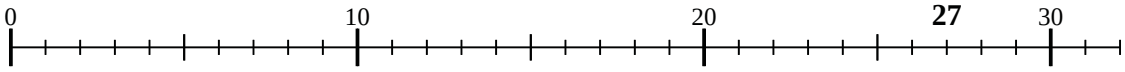

11) 14 ÷ 7 =

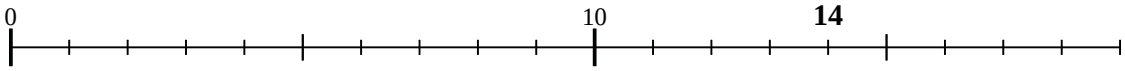

Answers

1. _____
2. _____
3. _____
4. _____
5. _____
6. _____
7. _____
8. _____
9. _____
10. _____
11. _____

1-10	91	82	73	64	55	45	36	27	18	9
11	0									

Dividing with a Numberline

Name: **Answer Key**

Use the numberline to solve each problem.

1) 50 ÷ 10 =

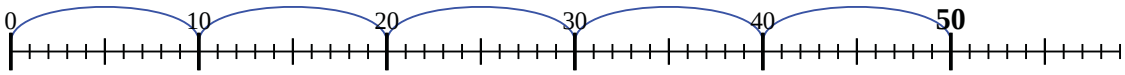

2) 20 ÷ 4 =

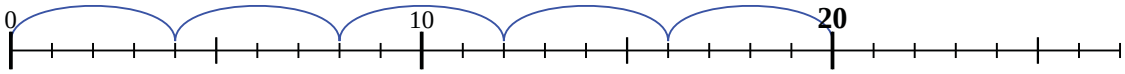

3) 18 ÷ 9 =

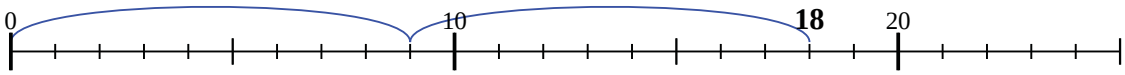

4) 15 ÷ 3 =

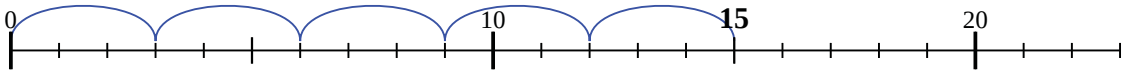

5) 28 ÷ 7 =

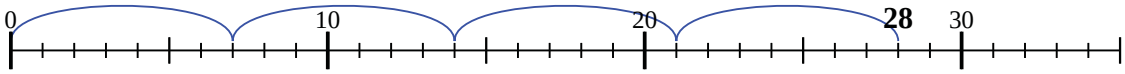

6) 21 ÷ 7 =

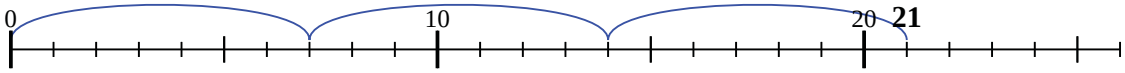

7) 25 ÷ 5 =

8) 16 ÷ 4 =

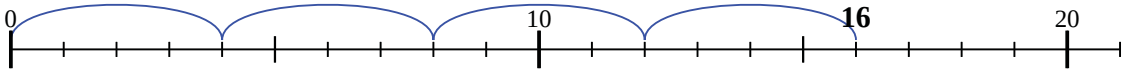

9) 6 ÷ 2 =

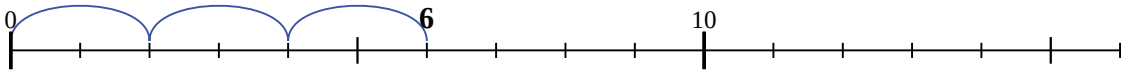

10) 27 ÷ 9 =

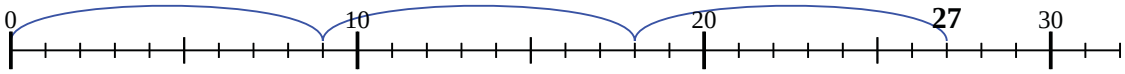

11) 14 ÷ 7 =

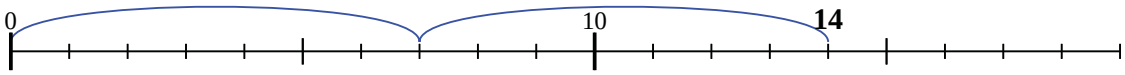

Answers

1. 5
2. 5
3. 2
4. 5
5. 4
6. 3
7. 5
8. 4
9. 3
10. 3
11. 2

1-10	91	82	73	64	55	45	36	27	18	9
11	0									