Dividing with a Numberline

Name:

Use the numberline to solve each problem.

1) 32 ÷ 8 =

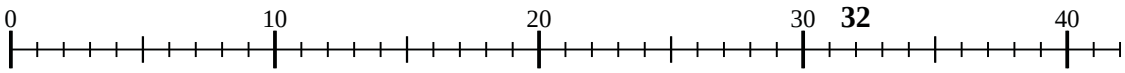

2) 36 ÷ 9 =

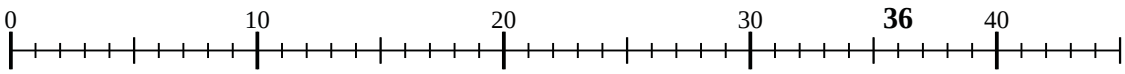

3) 30 ÷ 6 =

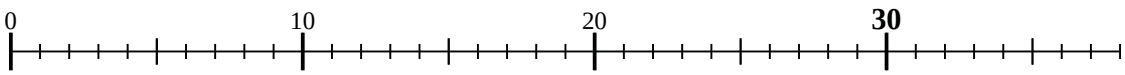

4) 12 ÷ 3 =

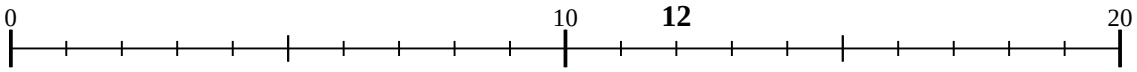

5) 24 ÷ 8 =

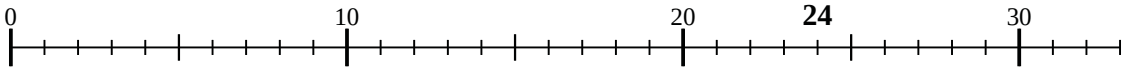

6) 30 ÷ 10 =

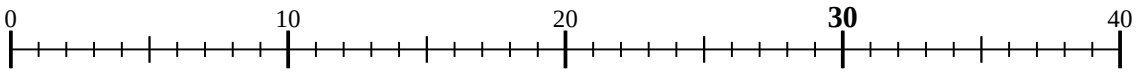

7) 12 ÷ 6 =

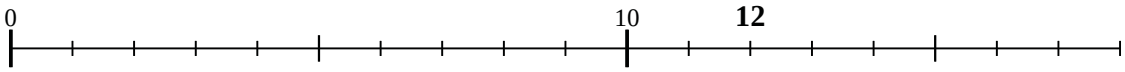

8) 28 ÷ 7 =

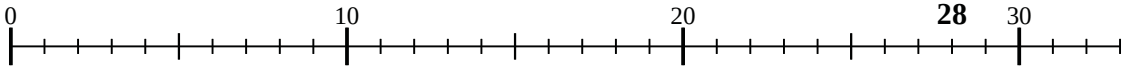

9) 40 ÷ 8 =

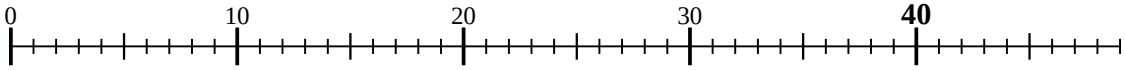

10) 8 ÷ 2 =

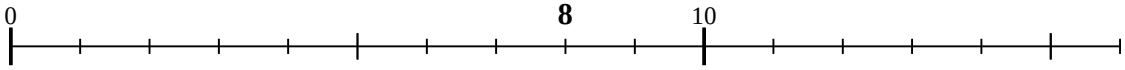

11) 25 ÷ 5 =

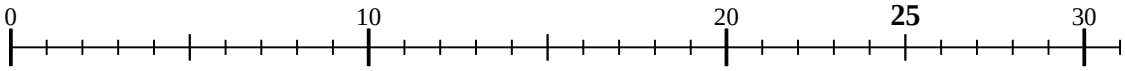

Answers

1. _____
2. _____
3. _____
4. _____
5. _____
6. _____
7. _____
8. _____
9. _____
10. _____
11. _____

1-10	91	82	73	64	55	45	36	27	18	9
11	0									

Dividing with a Numberline

Name: **Answer Key**

Use the numberline to solve each problem.

1) 32 ÷ 8 =

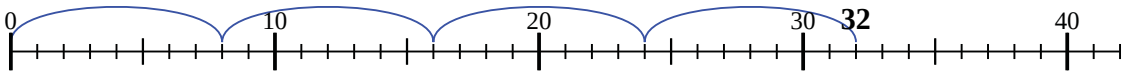

2) 36 ÷ 9 =

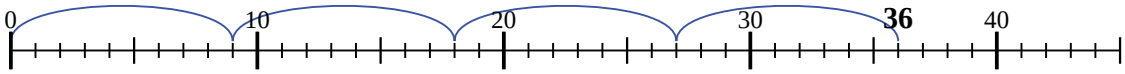

3) 30 ÷ 6 =

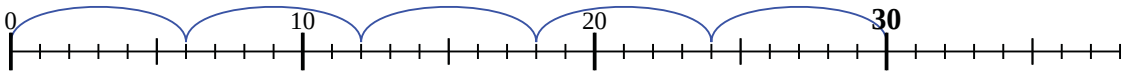

4) 12 ÷ 3 =

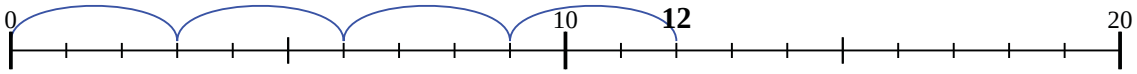

5) 24 ÷ 8 =

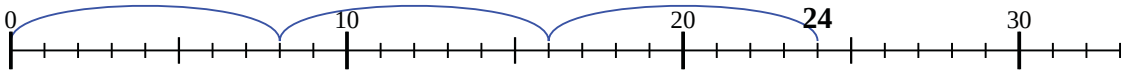

6) 30 ÷ 10 =

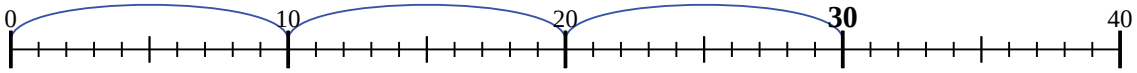

7) 12 ÷ 6 =

8) 28 ÷ 7 =

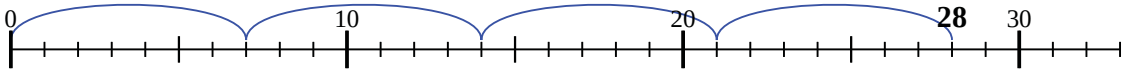

9) 40 ÷ 8 =

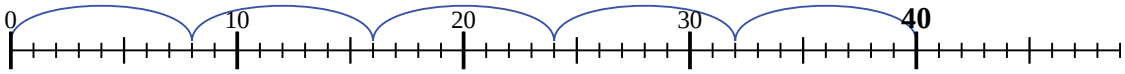

10) 8 ÷ 2 =

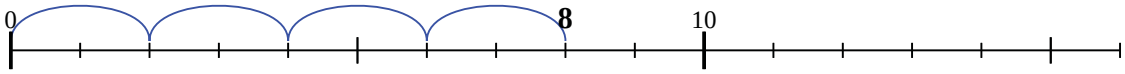

11) 25 ÷ 5 =

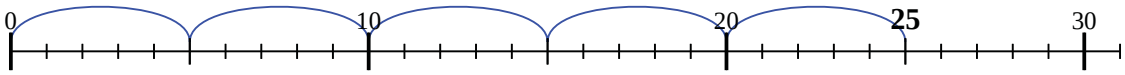

Answers

1. **4**
2. **4**
3. **5**
4. **4**
5. **3**
6. **3**
7. **2**
8. **4**
9. **5**
10. **4**
11. **5**

1-10	91	82	73	64	55	45	36	27	18	9
11	0									