Counting Figures

Name:

Count the number of shapes in each box.



= 4

= _____

= _____

= _____

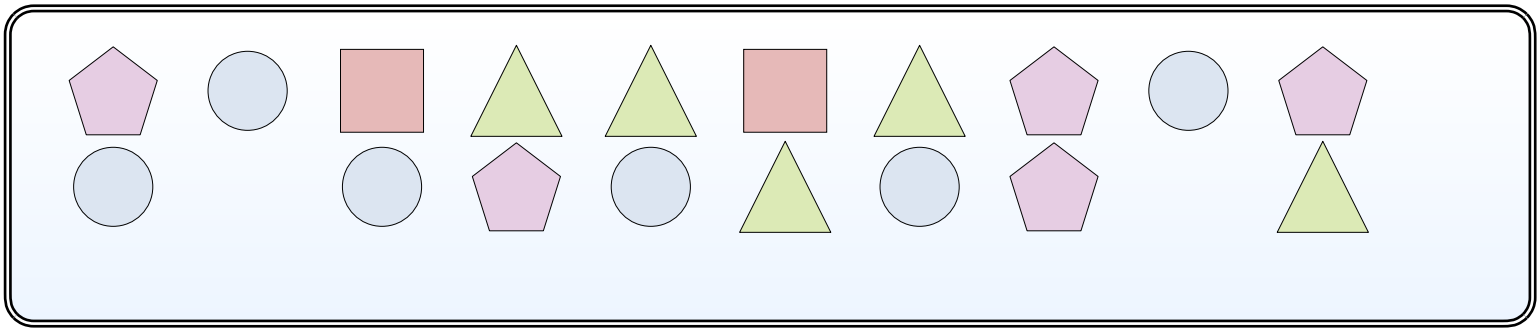

= _____

= _____

= _____

= _____



= _____

= _____

 = _____

= _____

1-10	91	82	73	64	55	45	36	27	18	9
11	0									

Counting Figures

Name: **Answer Key**

Count the number of shapes in each box.



= 4

= 4

= 3

= 5

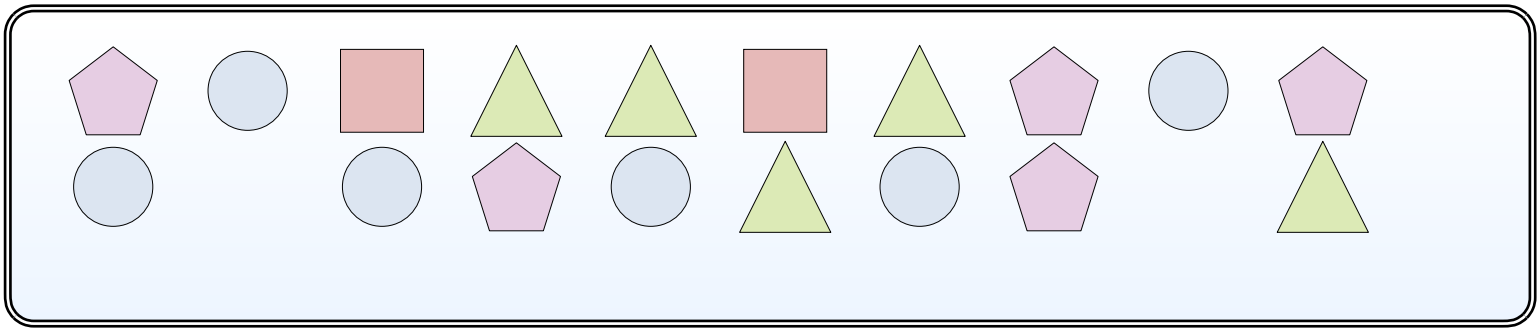

= 5

= 6

= 2

= 5



= 7

= 3

 = 4

= 5

1-10	91	82	73	64	55	45	36	27	18	9
11	0									