Finding Angles within Shapes

Name:

Count the number of Acute, Obtuse and Right angles inside each shape.

Ex)

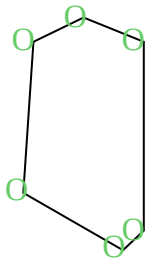

1)

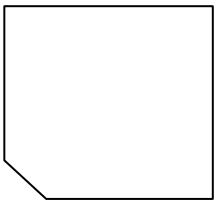

2)

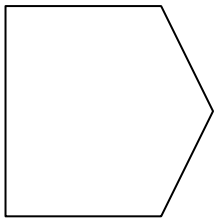

3)

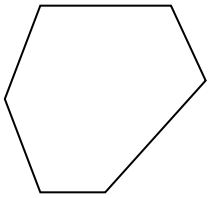

4)

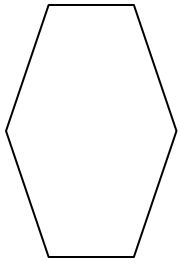

5)

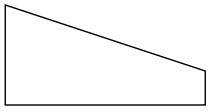

6)

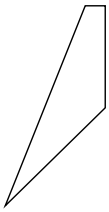

7)

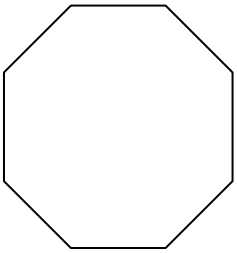

8)



9)



10)

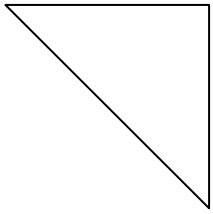

11)

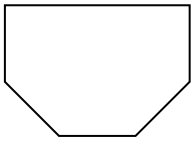

Answers

	A	O	R
Ex.	0	6	0
1.			
2.			
3.			
4.			
5.			
6.			
7.			
8.			
9.			
10.			
11.			

1-10	91	82	73	64	55	45	36	27	18	9
11	0									

Finding Angles within Shapes

Name: **Answer Key**

Count the number of Acute, Obtuse and Right angles inside each shape.

Ex)

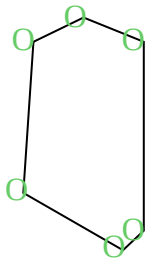

1)

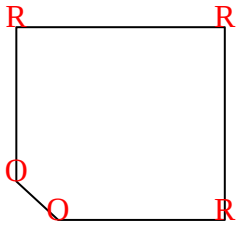

2)

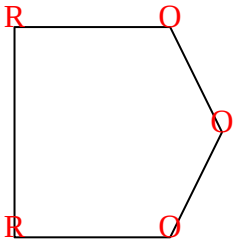

3)

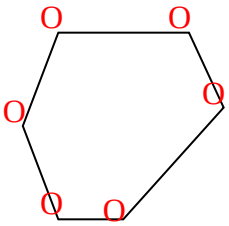

4)

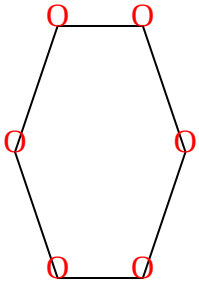

5)

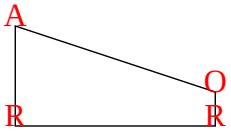

6)

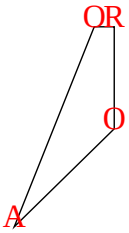

7)

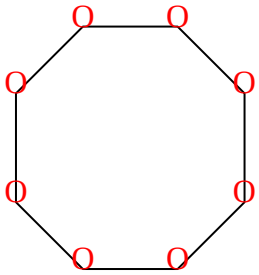

8)



9)

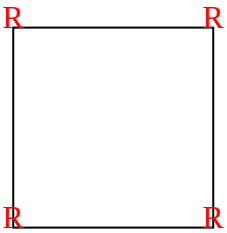

10)

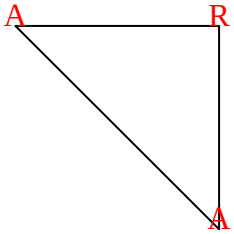

11)

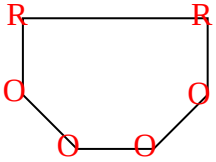

Answers

	A	O	R
Ex.	0	6	0
1.	0	2	3
2.	0	3	2
3.	0	6	0
4.	0	6	0
5.	1	1	2
6.	1	2	1
7.	0	8	0
8.	0	0	4
9.	0	0	4
10.	2	0	1
11.	0	4	2

1-10	91	82	73	64	55	45	36	27	18	9
11	0									