Rewriting Multiplication Problems (visual)

Name:

Write each array as a multipication problem and solve.

Ex)



1)



2)

3)

4)



5)

6)



7)

8)



9)



10)



11)



Answers

Ex. 8 × 7 = 56

1. _____
2. _____
3. _____
4. _____
5. _____
6. _____
7. _____
8. _____
9. _____
10. _____
11. _____

1-10	91	82	73	64	55	45	36	27	18	9
11	0									

Rewriting Multiplication Problems (visual) Name: **Answer Key**

Write each array as a multipication problem and solve.

Ex) 

1) 

2)

3)

4) 

5)

6) 

7)

8) 

9) 

10) 

11) 

Answers

Ex.	8 × 7 = 56
1.	4 × 6 = 24
2.	7 × 7 = 49
3.	3 × 8 = 24
4.	8 × 10 = 80
5.	2 × 3 = 6
6.	4 × 9 = 36
7.	2 × 8 = 16
8.	6 × 9 = 54
9.	10 × 9 = 90
10.	9 × 3 = 27
11.	10 × 10 = 100

1-10	91	82	73	64	55	45	36	27	18	9
11	0									