Rewriting Multiplication Problems (visual)

Name:

Write each array as a multipication problem and solve.

Ex)



1)



2)



3)



4)



5)



6)

7)

8)



9)



10)

11)

Answers

Ex. 9 × 10 = 90

1. _____
2. _____
3. _____
4. _____
5. _____
6. _____
7. _____
8. _____
9. _____
10. _____
11. _____

1-10	91	82	73	64	55	45	36	27	18	9
11	0									

Rewriting Multiplication Problems (visual) Name: **Answer Key**

Write each array as a multipication problem and solve.

Ex) 

1) 

2) 

3) 

4) 

5) 

6)

7)

8)

9) 

10)

11)

Answers

Ex.	9 × 10 = 90
1.	8 × 8 = 64
2.	10 × 8 = 80
3.	6 × 6 = 36
4.	5 × 8 = 40
5.	7 × 6 = 42
6.	3 × 2 = 6
7.	3 × 9 = 27
8.	7 × 5 = 35
9.	7 × 2 = 14
10.	9 × 2 = 18
11.	2 × 9 = 18

1-10	91	82	73	64	55	45	36	27	18	9
11	0									