Rewriting Multiplication Problems (visual)

Name:

Write each array as a multipication problem and solve.

Ex) 

1) 

2) 

3) 

4) 

5)

6)

7) 

8) 

9) 

10) 

11)

Answers

Ex. $2 \times 4 = 8$

1. _____
2. _____
3. _____
4. _____
5. _____
6. _____
7. _____
8. _____
9. _____
10. _____
11. _____

1-10	91	82	73	64	55	45	36	27	18	9
11	0									

Rewriting Multiplication Problems (visual) Name: **Answer Key**

Write each array as a multipication problem and solve.

Ex) 

1) 

2) 

3) 

4) 

5)

6)

7) 

8) 

9) 

10) 

11)

Answers

Ex. 2 × 4 = 8

1. 8 × 10 = 80
2. 8 × 8 = 64
3. 8 × 9 = 72
4. 10 × 10 = 100
5. 5 × 3 = 15
6. 6 × 2 = 12
7. 6 × 6 = 36
8. 8 × 5 = 40
9. 10 × 3 = 30
10. 6 × 10 = 60
11. 3 × 4 = 12

1-10	91	82	73	64	55	45	36	27	18	9
11	0									