Rewriting Multiplication Problems (visual)

Name:

Write each array as a multipication problem and solve.

Ex)



1)



2)

3)



4)

5)



6)



7)



8)

9)



10)



11)

Answers

Ex. 9 × 10 = 90

1. _____
2. _____
3. _____
4. _____
5. _____
6. _____
7. _____
8. _____
9. _____
10. _____
11. _____

1-10	91	82	73	64	55	45	36	27	18	9
11	0									

Rewriting Multiplication Problems (visual) Name: **Answer Key**

Write each array as a multipication problem and solve.

Ex) 

1) 

2)

3) 

4)

5) 

6) 

7)

8)

9) 

10) 

11)

Answers

Ex. 9 × 10 = 90

1. 5 × 4 = 20
2. 6 × 5 = 30
3. 5 × 10 = 50
4. 4 × 4 = 16
5. 10 × 9 = 90
6. 8 × 10 = 80
7. 5 × 6 = 30
8. 3 × 4 = 12
9. 9 × 4 = 36
10. 7 × 7 = 49
11. 8 × 2 = 16

1-10	91	82	73	64	55	45	36	27	18	9
11	0									