Visual Division

Name:

Use the shapes provided to answer the questions.

Ex) How many groups of 6 can you make with the 18 shapes below?

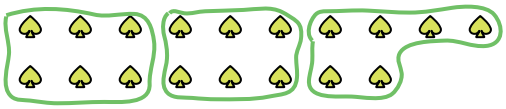

1) How many groups of 6 can you make with the 18 shapes below?

2) How many groups of 2 can you make with the 40 shapes below?



3) How many groups of 5 can you make with the 20 shapes below?

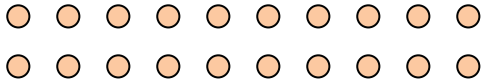

4) How many groups of 7 can you make with the 21 shapes below?

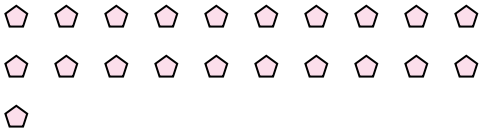

5) How many groups of 6 can you make with the 36 shapes below?



6) How many groups of 7 can you make with the 28 shapes below?



7) How many groups of 8 can you make with the 16 shapes below?

8) How many groups of 9 can you make with the 18 shapes below?

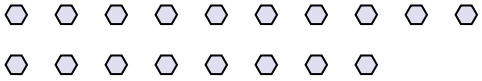

9) How many groups of 6 can you make with the 12 shapes below?

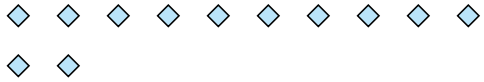

10) How many groups of 4 can you make with the 20 shapes below?

11) How many groups of 6 can you make with the 18 shapes below?

Answers

Ex. 3

1. _____
2. _____
3. _____
4. _____
5. _____
6. _____
7. _____
8. _____
9. _____
10. _____
11. _____

1-10	91	82	73	64	55	45	36	27	18	9
11	0									

Visual Division

Name: **Answer Key**

Use the shapes provided to answer the questions.

Ex) How many groups of 6 can you make with the 18 shapes below?

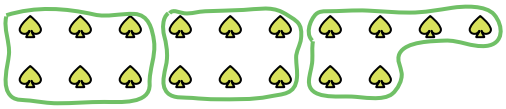

1) How many groups of 6 can you make with the 18 shapes below?

2) How many groups of 2 can you make with the 40 shapes below?



3) How many groups of 5 can you make with the 20 shapes below?

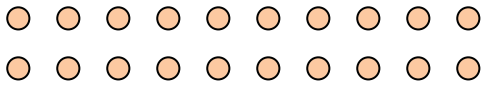

4) How many groups of 7 can you make with the 21 shapes below?

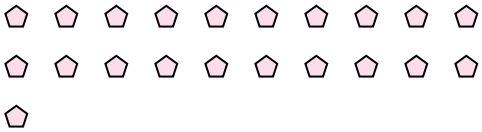

5) How many groups of 6 can you make with the 36 shapes below?



6) How many groups of 7 can you make with the 28 shapes below?



7) How many groups of 8 can you make with the 16 shapes below?

8) How many groups of 9 can you make with the 18 shapes below?

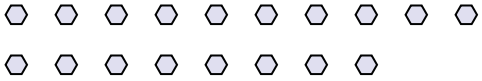

9) How many groups of 6 can you make with the 12 shapes below?

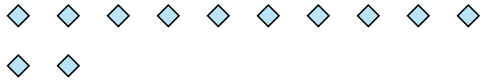

10) How many groups of 4 can you make with the 20 shapes below?

11) How many groups of 6 can you make with the 18 shapes below?

Answers

Ex.	3
1.	3
2.	20
3.	4
4.	3
5.	6
6.	4
7.	2
8.	2
9.	2
10.	5
11.	3

1-10	91	82	73	64	55	45	36	27	18	9
11	0									