Dividing with a Numberline

Name:

Use the numberline to solve each problem.

1) 4 ÷ 2 =

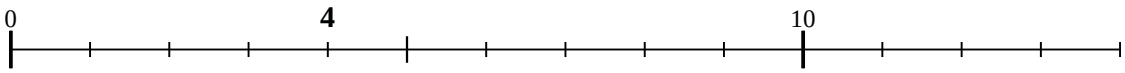

2) 12 ÷ 3 =

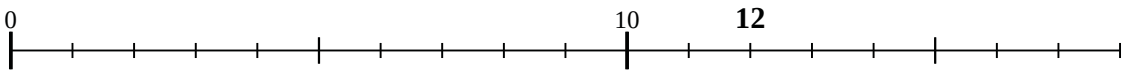

3) 15 ÷ 3 =

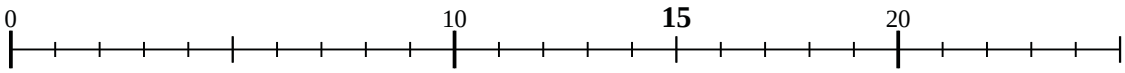

4) 30 ÷ 10 =

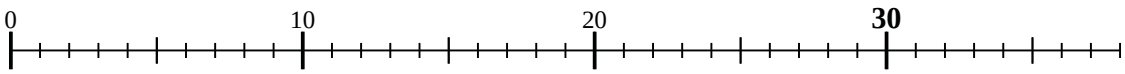

5) 8 ÷ 4 =

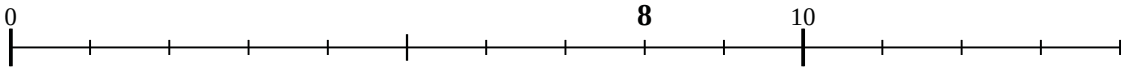

6) 12 ÷ 4 =

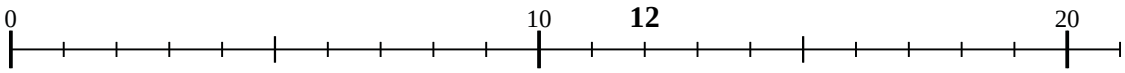

7) 8 ÷ 2 =

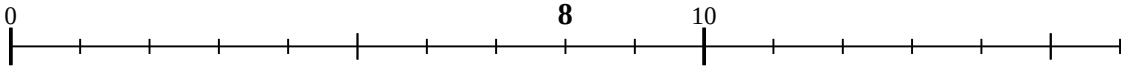

8) 24 ÷ 8 =

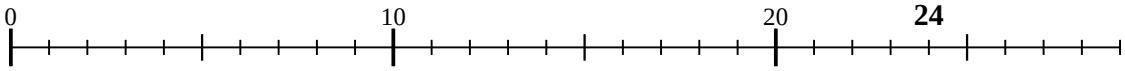

9) 30 ÷ 6 =

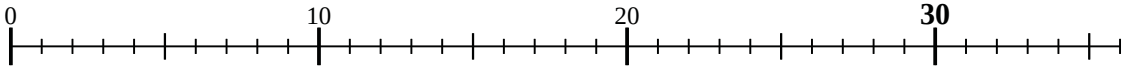

10) 20 ÷ 4 =

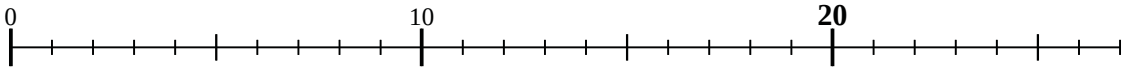

11) 18 ÷ 6 =

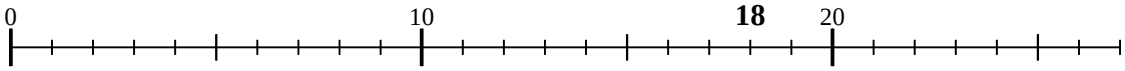

Answers

1. _____
2. _____
3. _____
4. _____
5. _____
6. _____
7. _____
8. _____
9. _____
10. _____
11. _____

1-10	91	82	73	64	55	45	36	27	18	9
11	0									

Dividing with a Numberline

Name: **Answer Key**

Use the numberline to solve each problem.

1) 4 ÷ 2 =

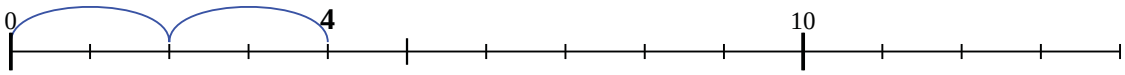

2) 12 ÷ 3 =

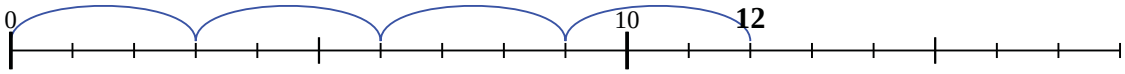

3) 15 ÷ 3 =

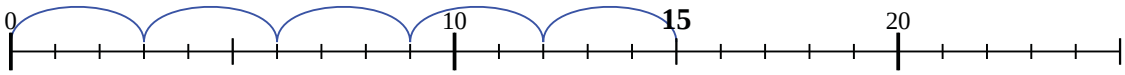

4) 30 ÷ 10 =



5) 8 ÷ 4 =

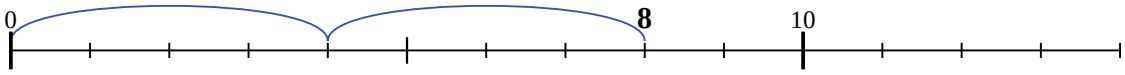

6) 12 ÷ 4 =

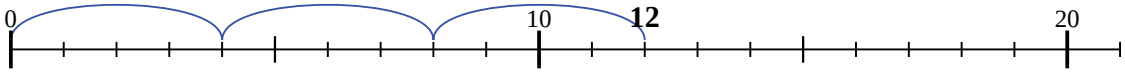

7) 8 ÷ 2 =

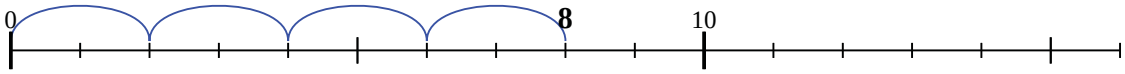

8) 24 ÷ 8 =

9) 30 ÷ 6 =

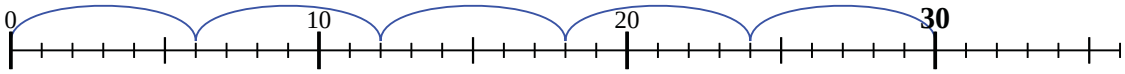

10) 20 ÷ 4 =

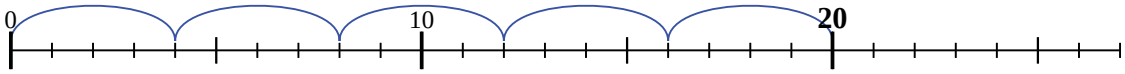

11) 18 ÷ 6 =



Answers

1. 2
2. 4
3. 5
4. 3
5. 2
6. 3
7. 4
8. 3
9. 5
10. 5
11. 3

1-10	91	82	73	64	55	45	36	27	18	9
11	0									

Dividing with a Numberline

Name:

Use the numberline to solve each problem.

1) 32 ÷ 8 =

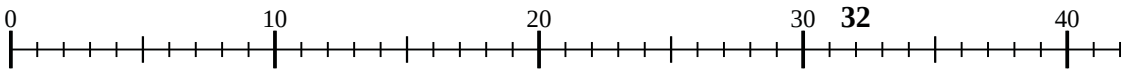

2) 36 ÷ 9 =

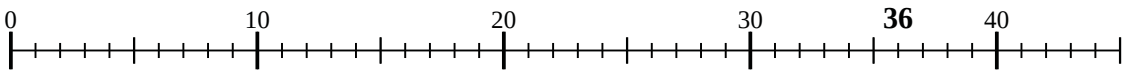

3) 30 ÷ 6 =

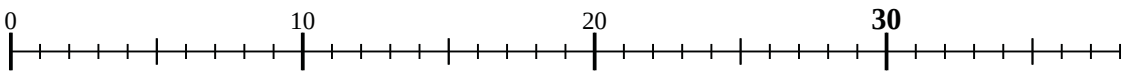

4) 12 ÷ 3 =

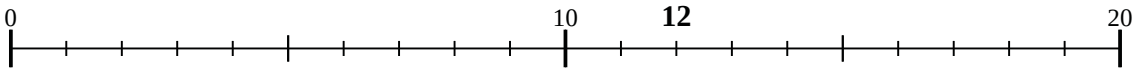

5) 24 ÷ 8 =

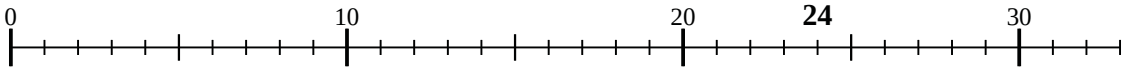

6) 30 ÷ 10 =

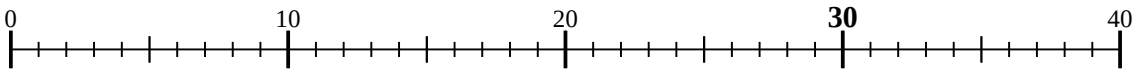

7) 12 ÷ 6 =

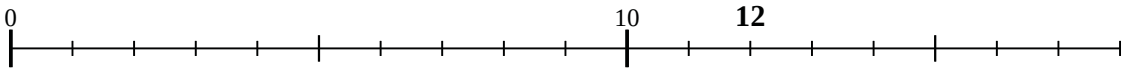

8) 28 ÷ 7 =

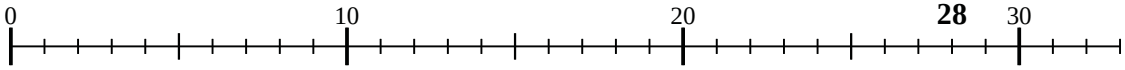

9) 40 ÷ 8 =

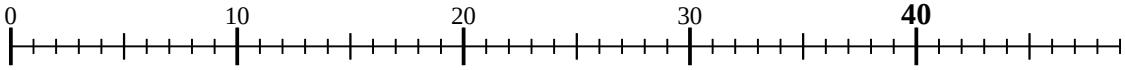

10) 8 ÷ 2 =

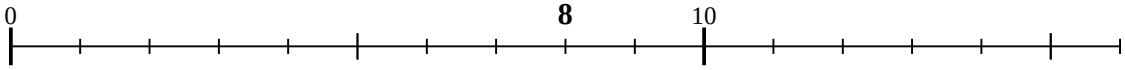

11) 25 ÷ 5 =

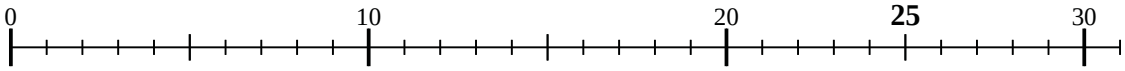

Answers

1. _____
2. _____
3. _____
4. _____
5. _____
6. _____
7. _____
8. _____
9. _____
10. _____
11. _____

1-10	91	82	73	64	55	45	36	27	18	9
11	0									

Dividing with a Numberline

Name: **Answer Key**

Use the numberline to solve each problem.

1) 32 ÷ 8 =

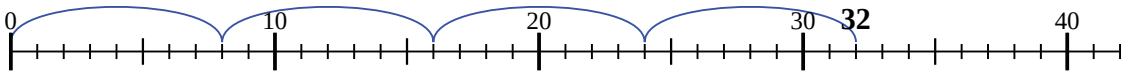

2) 36 ÷ 9 =

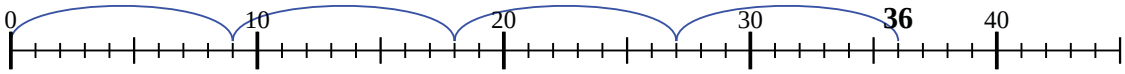

3) 30 ÷ 6 =

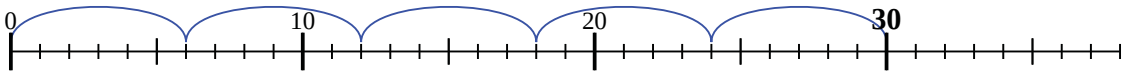

4) 12 ÷ 3 =

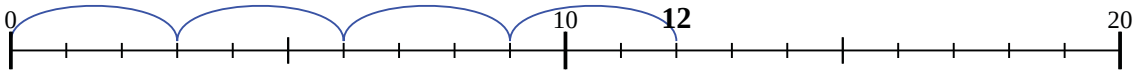

5) 24 ÷ 8 =

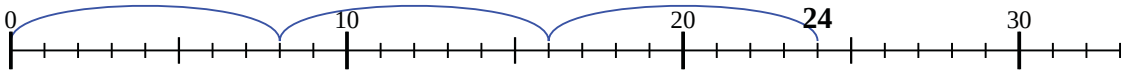

6) 30 ÷ 10 =

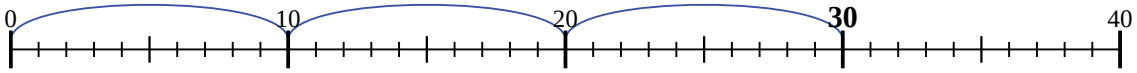

7) 12 ÷ 6 =

8) 28 ÷ 7 =

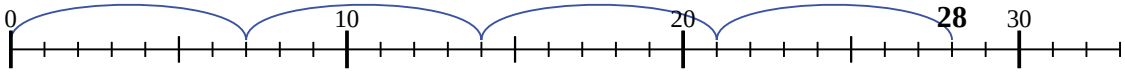

9) 40 ÷ 8 =

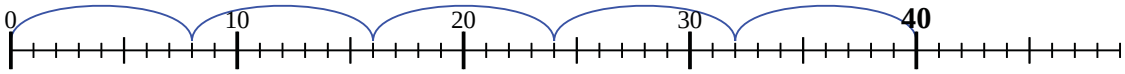

10) 8 ÷ 2 =

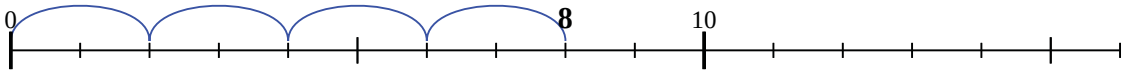

11) 25 ÷ 5 =

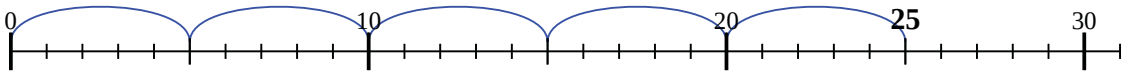

Answers

1. **4**
2. **4**
3. **5**
4. **4**
5. **3**
6. **3**
7. **2**
8. **4**
9. **5**
10. **4**
11. **5**

1-10	91	82	73	64	55	45	36	27	18	9
11	0									

Dividing with a Numberline

Name:

Use the numberline to solve each problem.

1) 15 ÷ 3 =

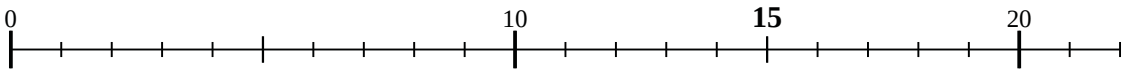

2) 12 ÷ 6 =

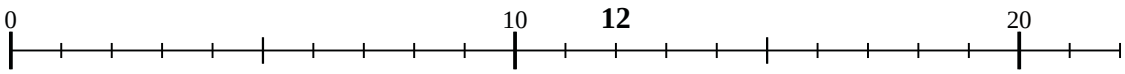

3) 6 ÷ 3 =

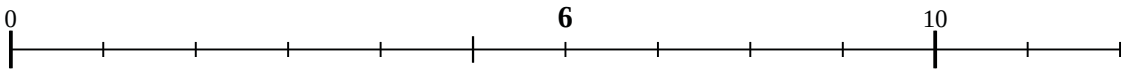

4) 14 ÷ 7 =

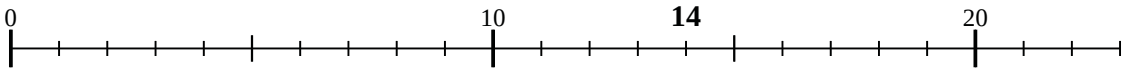

5) 16 ÷ 8 =

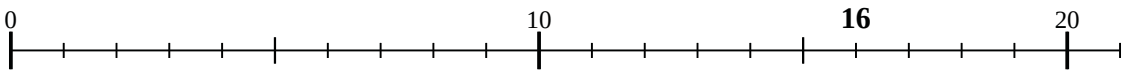

6) 18 ÷ 6 =

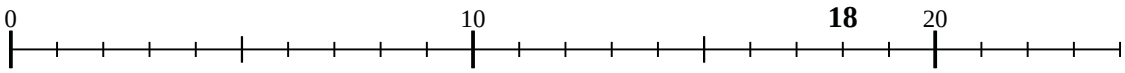

7) 30 ÷ 10 =

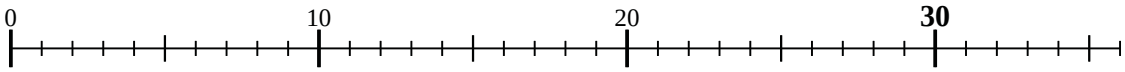

8) 20 ÷ 4 =

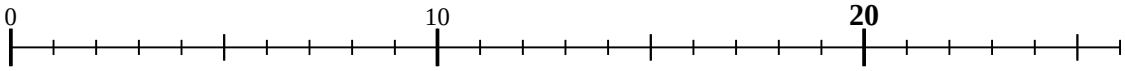

9) 10 ÷ 2 =

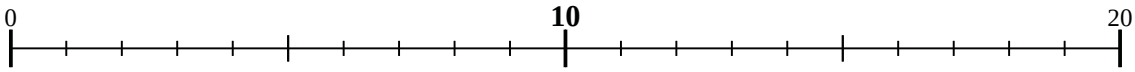

10) 10 ÷ 5 =

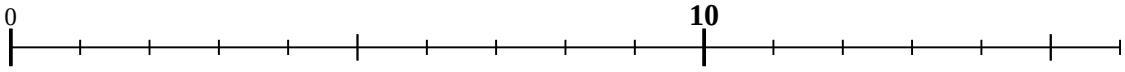

11) 35 ÷ 7 =

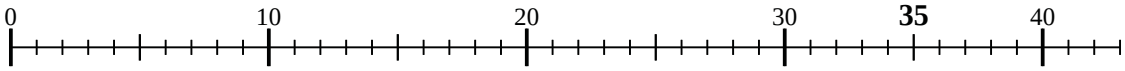

Answers

1. _____
2. _____
3. _____
4. _____
5. _____
6. _____
7. _____
8. _____
9. _____
10. _____
11. _____

1-10	91	82	73	64	55	45	36	27	18	9
11	0									

Dividing with a Numberline

Name: **Answer Key**

Use the numberline to solve each problem.

1) 15 ÷ 3 =

2) 12 ÷ 6 =

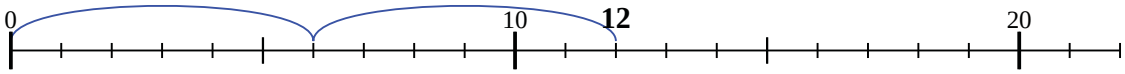

3) 6 ÷ 3 =

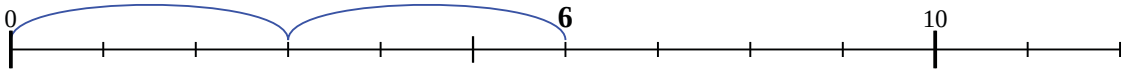

4) 14 ÷ 7 =

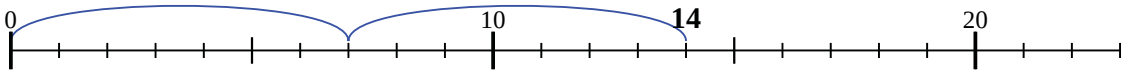

5) 16 ÷ 8 =

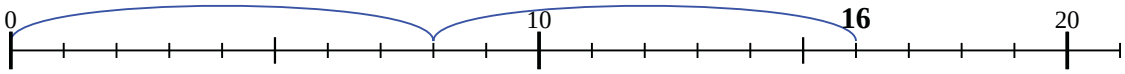

6) 18 ÷ 6 =

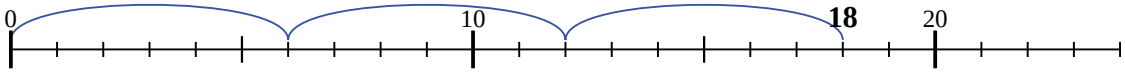

7) 30 ÷ 10 =

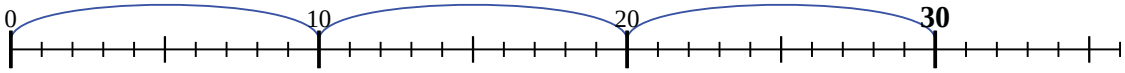

8) 20 ÷ 4 =

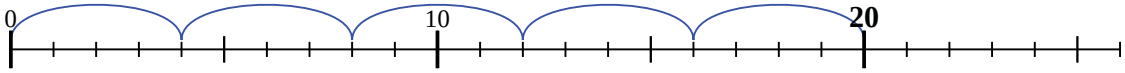

9) 10 ÷ 2 =

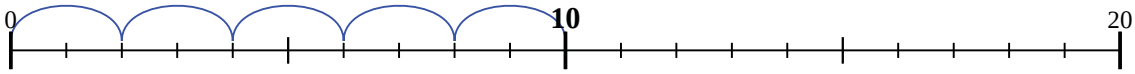

10) 10 ÷ 5 =

11) 35 ÷ 7 =

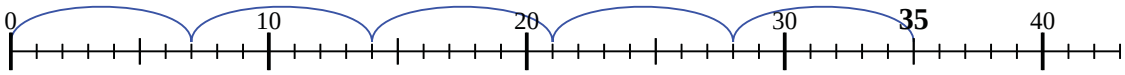

Answers

1. 5
2. 2
3. 2
4. 2
5. 2
6. 3
7. 3
8. 5
9. 5
10. 2
11. 5

1-10	91	82	73	64	55	45	36	27	18	9
11	0									

Dividing with a Numberline

Name:

Use the numberline to solve each problem.

1) 16 ÷ 8 =

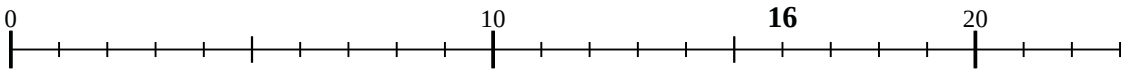

2) 8 ÷ 4 =

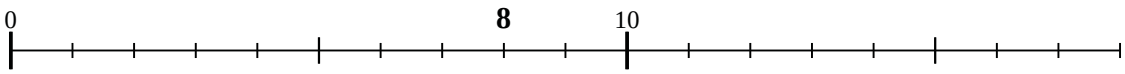

3) 20 ÷ 5 =

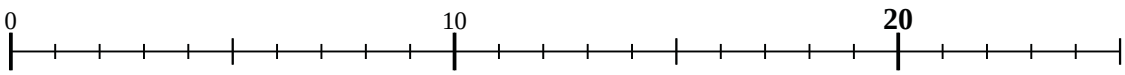

4) 15 ÷ 3 =

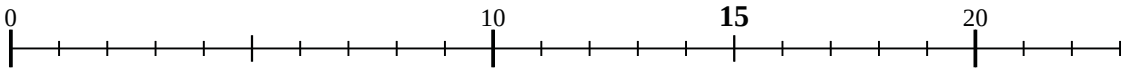

5) 6 ÷ 2 =

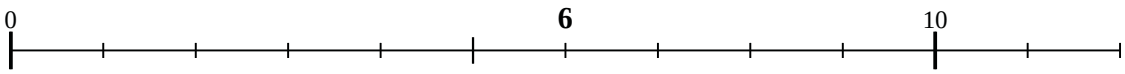

6) 25 ÷ 5 =

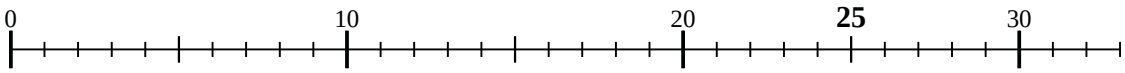

7) 12 ÷ 6 =

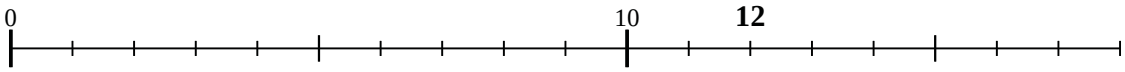

8) 16 ÷ 4 =

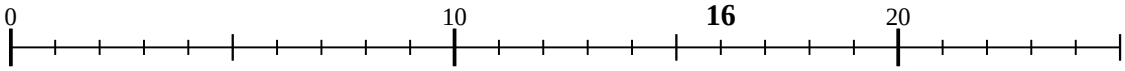

9) 18 ÷ 9 =

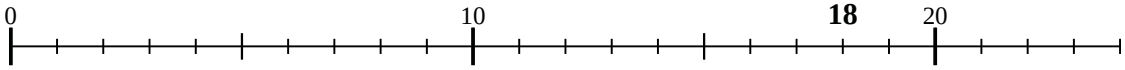

10) 45 ÷ 9 =

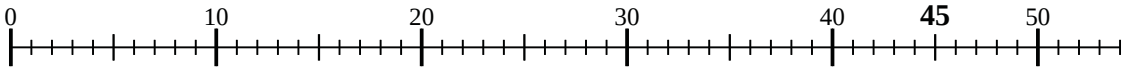

11) 24 ÷ 6 =

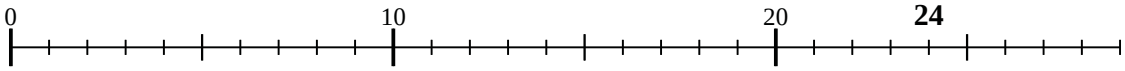

Answers

1. _____
2. _____
3. _____
4. _____
5. _____
6. _____
7. _____
8. _____
9. _____
10. _____
11. _____

1-10	91	82	73	64	55	45	36	27	18	9
11	0									

Dividing with a Numberline

Name: **Answer Key**

Use the numberline to solve each problem.

1) 16 ÷ 8 =

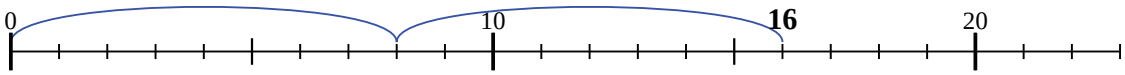

2) 8 ÷ 4 =

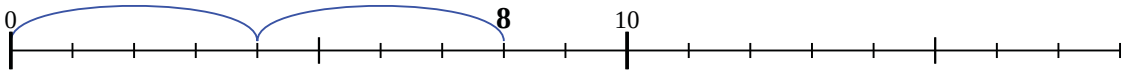

3) 20 ÷ 5 =

4) 15 ÷ 3 =

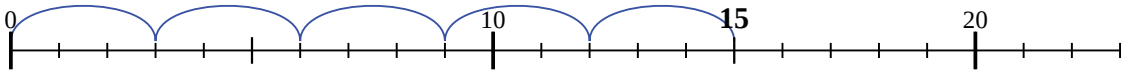

5) 6 ÷ 2 =

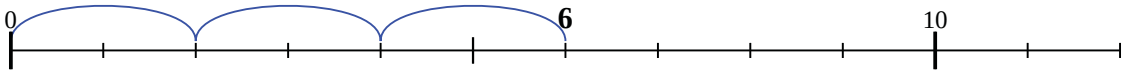

6) 25 ÷ 5 =

7) 12 ÷ 6 =

8) 16 ÷ 4 =

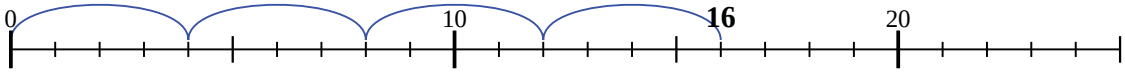

9) 18 ÷ 9 =

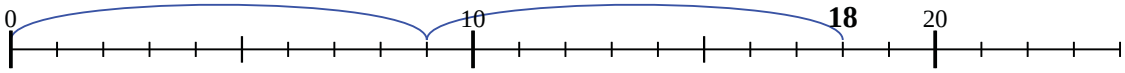

10) 45 ÷ 9 =

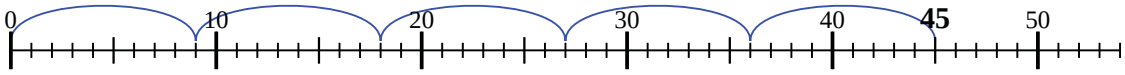

11) 24 ÷ 6 =

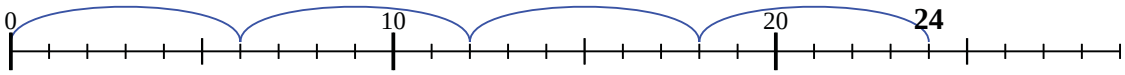

Answers

1. **2**
2. **2**
3. **4**
4. **5**
5. **3**
6. **5**
7. **2**
8. **4**
9. **2**
10. **5**
11. **4**

1-10	91	82	73	64	55	45	36	27	18	9
11	0									

Dividing with a Numberline

Name:

Use the numberline to solve each problem.

1) 24 ÷ 6 =

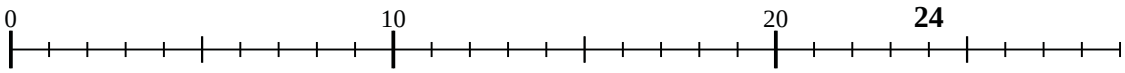

2) 25 ÷ 5 =

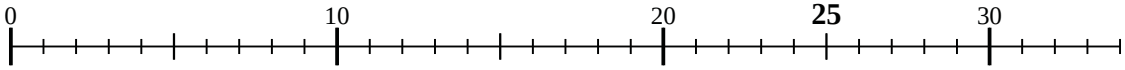

3) 9 ÷ 3 =

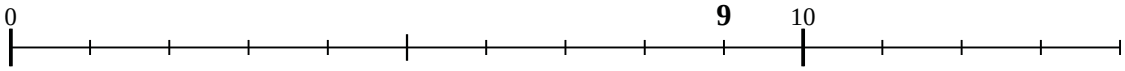

4) 12 ÷ 3 =

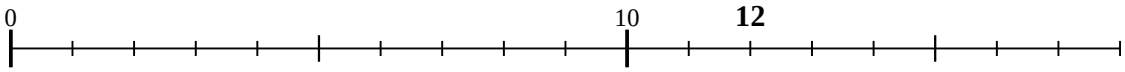

5) 50 ÷ 10 =

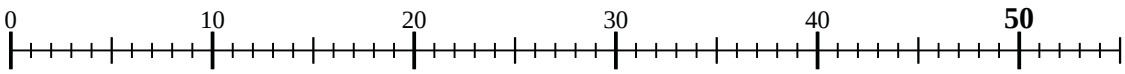

6) 15 ÷ 5 =

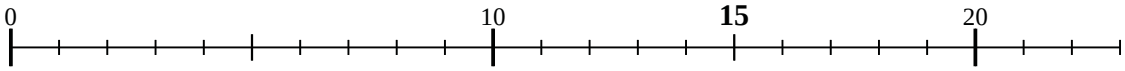

7) 20 ÷ 4 =

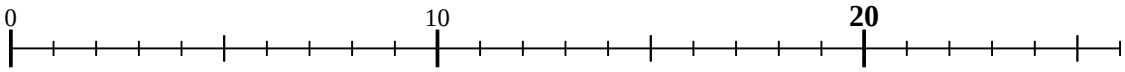

8) 36 ÷ 9 =

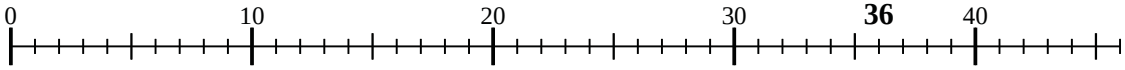

9) 20 ÷ 5 =

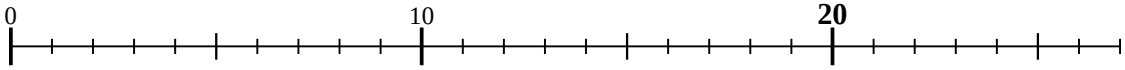

10) 8 ÷ 2 =



11) 18 ÷ 9 =

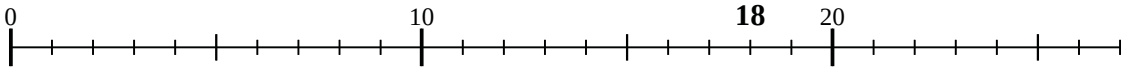

Answers

1. _____
2. _____
3. _____
4. _____
5. _____
6. _____
7. _____
8. _____
9. _____
10. _____
11. _____

1-10	91	82	73	64	55	45	36	27	18	9
11	0									

Dividing with a Numberline

Name: **Answer Key**

Use the numberline to solve each problem.

1) 24 ÷ 6 =

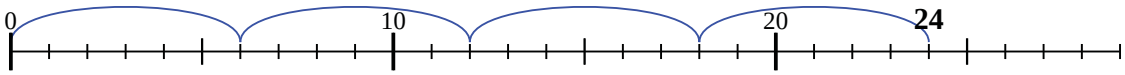

2) 25 ÷ 5 =

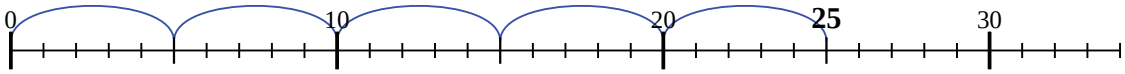

3) 9 ÷ 3 =

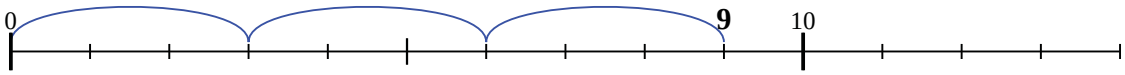

4) 12 ÷ 3 =

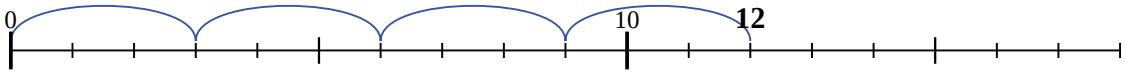

5) 50 ÷ 10 =

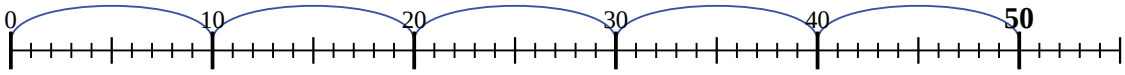

6) 15 ÷ 5 =

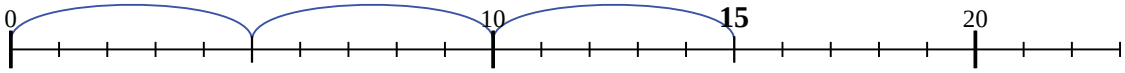

7) 20 ÷ 4 =

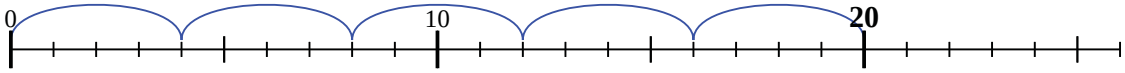

8) 36 ÷ 9 =

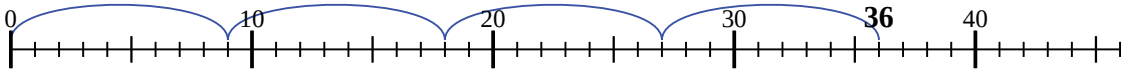

9) 20 ÷ 5 =

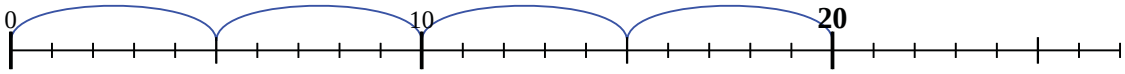

10) 8 ÷ 2 =

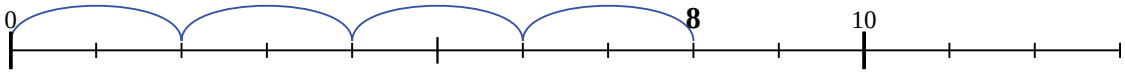

11) 18 ÷ 9 =

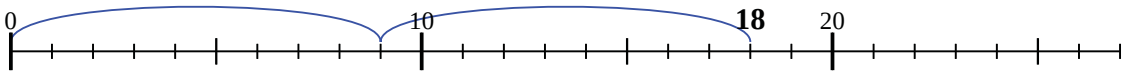

Answers

1. 4
2. 5
3. 3
4. 4
5. 5
6. 3
7. 5
8. 4
9. 4
10. 4
11. 2

1-10	91	82	73	64	55	45	36	27	18	9
11	0									

Dividing with a Numberline

Name:

Use the numberline to solve each problem.

1) 16 ÷ 8 =

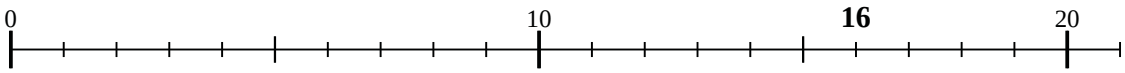

2) 35 ÷ 7 =

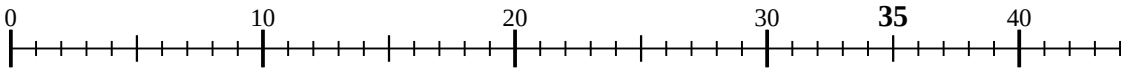

3) 30 ÷ 10 =

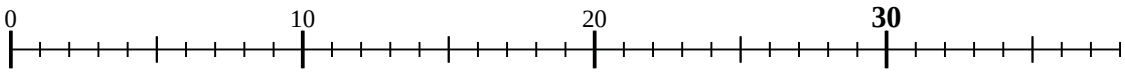

4) 36 ÷ 9 =

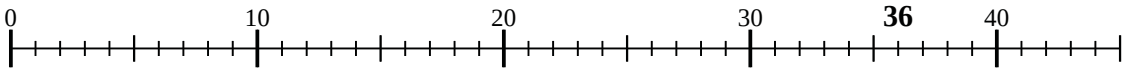

5) 27 ÷ 9 =

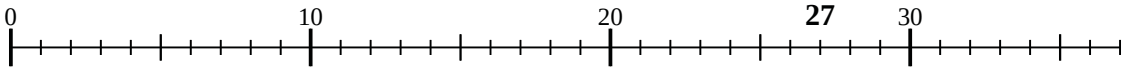

6) 20 ÷ 5 =

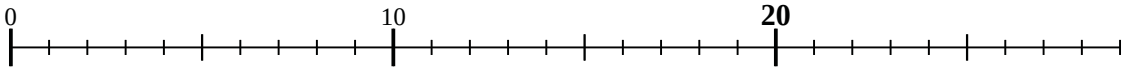

7) 20 ÷ 4 =

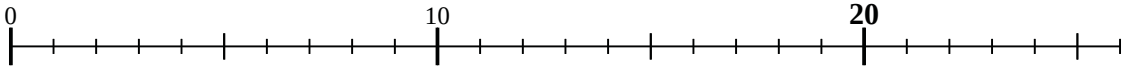

8) 18 ÷ 9 =

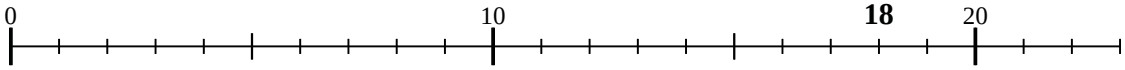

9) 20 ÷ 10 =

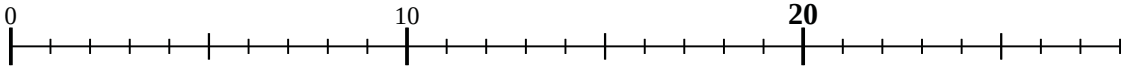

10) 12 ÷ 3 =

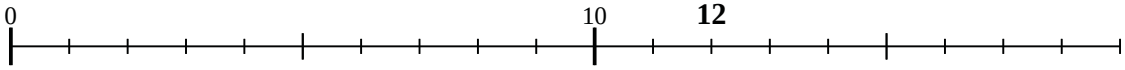

11) 15 ÷ 3 =

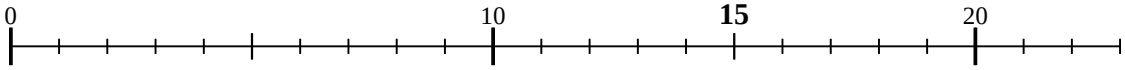

Answers

1. _____
2. _____
3. _____
4. _____
5. _____
6. _____
7. _____
8. _____
9. _____
10. _____
11. _____

1-10	91	82	73	64	55	45	36	27	18	9
11	0									

Dividing with a Numberline

Name: **Answer Key**

Use the numberline to solve each problem.

1) 16 ÷ 8 =

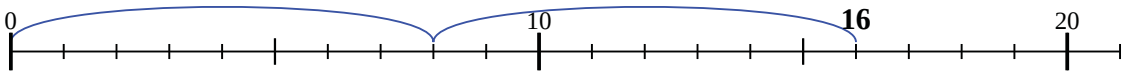

2) 35 ÷ 7 =

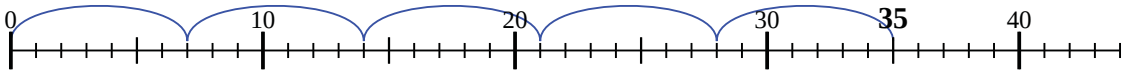

3) 30 ÷ 10 =



4) 36 ÷ 9 =

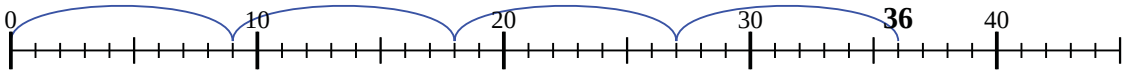

5) 27 ÷ 9 =

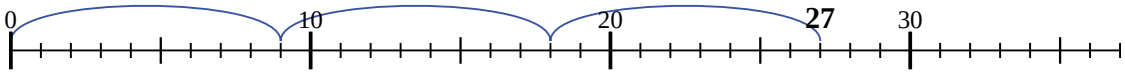

6) 20 ÷ 5 =

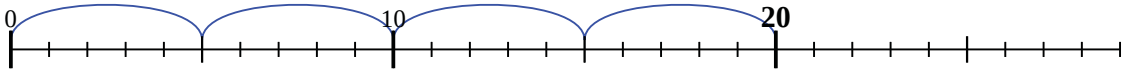

7) 20 ÷ 4 =

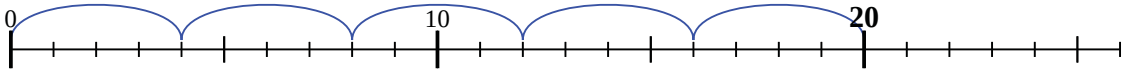

8) 18 ÷ 9 =

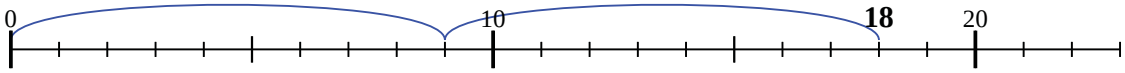

9) 20 ÷ 10 =

10) 12 ÷ 3 =

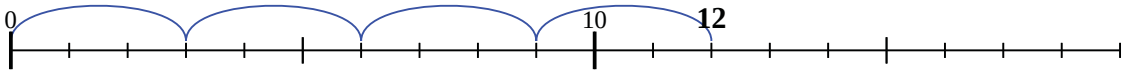

11) 15 ÷ 3 =

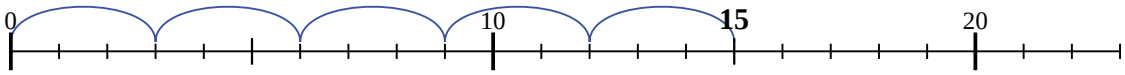

Answers

1. 2
2. 5
3. 3
4. 4
5. 3
6. 4
7. 5
8. 2
9. 2
10. 4
11. 5

1-10	91	82	73	64	55	45	36	27	18	9
11	0									

Dividing with a Numberline

Name:

Use the numberline to solve each problem.

1) 50 ÷ 10 =

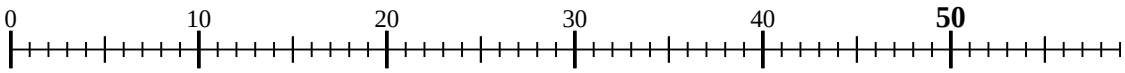

2) 20 ÷ 4 =

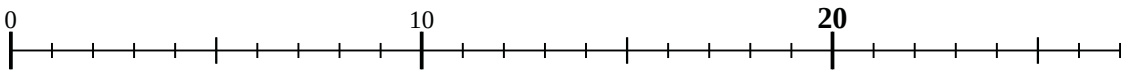

3) 18 ÷ 9 =

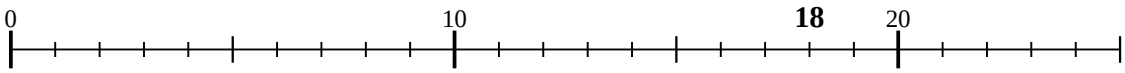

4) 15 ÷ 3 =

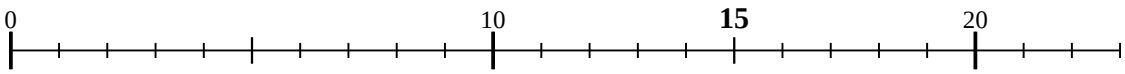

5) 28 ÷ 7 =

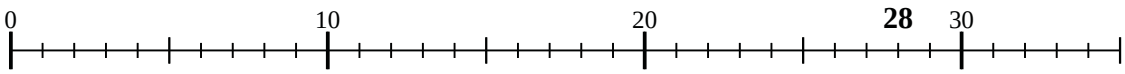

6) 21 ÷ 7 =

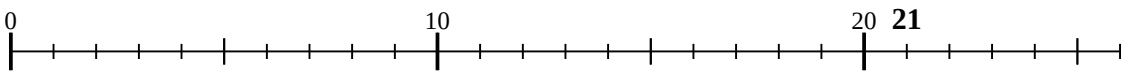

7) 25 ÷ 5 =

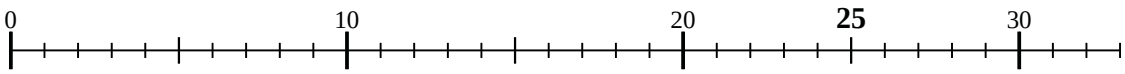

8) 16 ÷ 4 =

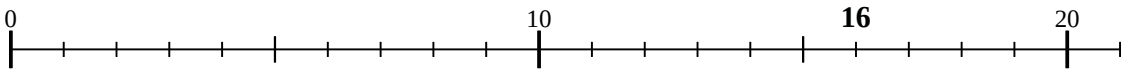

9) 6 ÷ 2 =

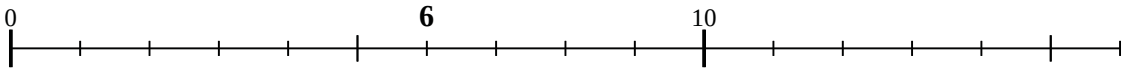

10) 27 ÷ 9 =

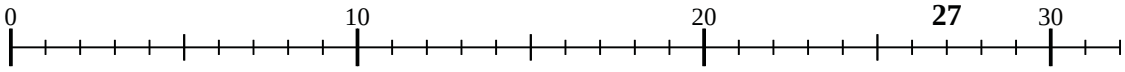

11) 14 ÷ 7 =

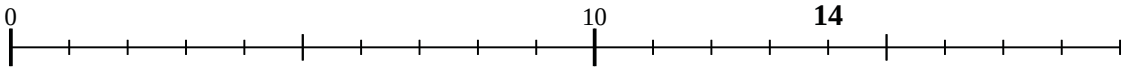

Answers

1. _____
2. _____
3. _____
4. _____
5. _____
6. _____
7. _____
8. _____
9. _____
10. _____
11. _____

1-10	91	82	73	64	55	45	36	27	18	9
11	0									

Dividing with a Numberline

Name: **Answer Key**

Use the numberline to solve each problem.

1) 50 ÷ 10 =

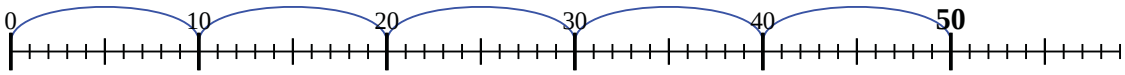

2) 20 ÷ 4 =

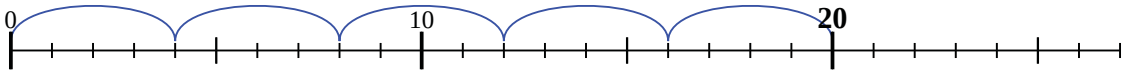

3) 18 ÷ 9 =

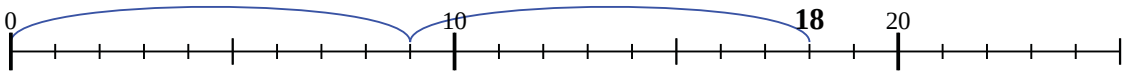

4) 15 ÷ 3 =

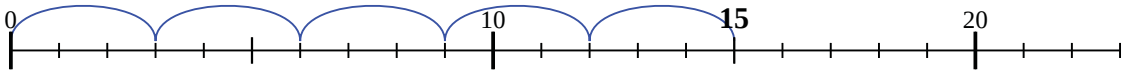

5) 28 ÷ 7 =

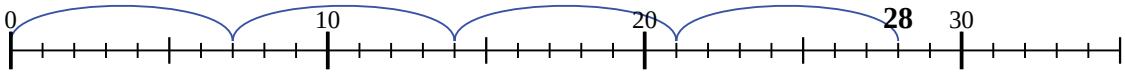

6) 21 ÷ 7 =

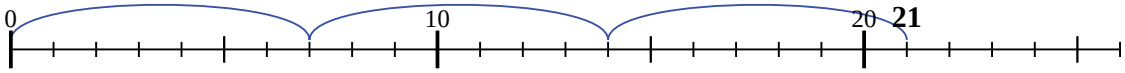

7) 25 ÷ 5 =

8) 16 ÷ 4 =

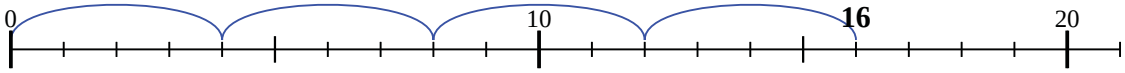

9) 6 ÷ 2 =

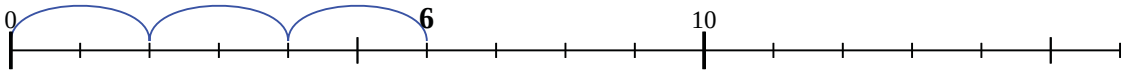

10) 27 ÷ 9 =

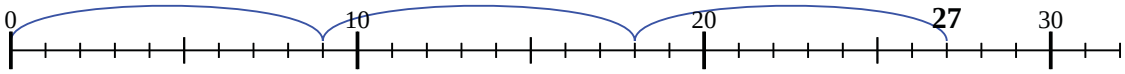

11) 14 ÷ 7 =

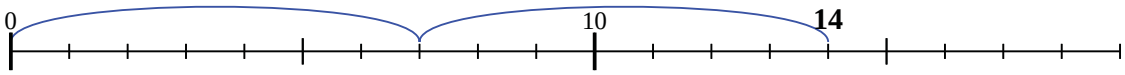

Answers

1. 5
2. 5
3. 2
4. 5
5. 4
6. 3
7. 5
8. 4
9. 3
10. 3
11. 2

1-10	91	82	73	64	55	45	36	27	18	9
11	0									

Dividing with a Numberline

Name:

Use the numberline to solve each problem.

1) 9 ÷ 3 =

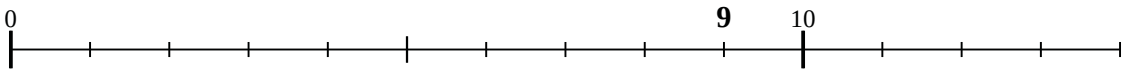

2) 12 ÷ 3 =

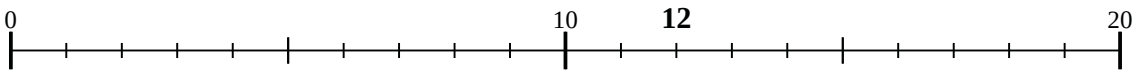

3) 6 ÷ 3 =

4) 16 ÷ 4 =

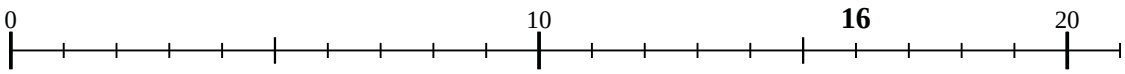

5) 20 ÷ 5 =

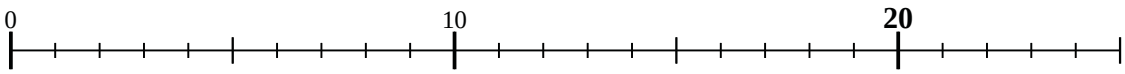

6) 24 ÷ 6 =

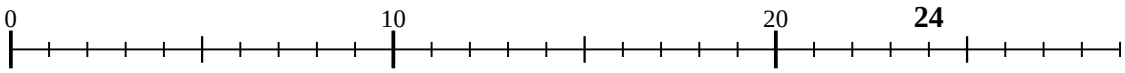

7) 40 ÷ 8 =

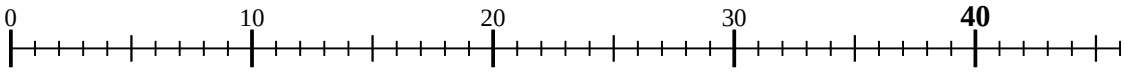

8) 36 ÷ 9 =

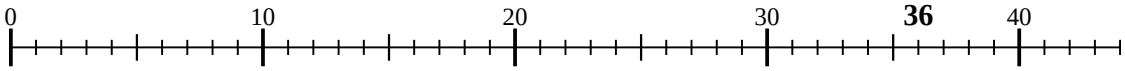

9) 10 ÷ 2 =

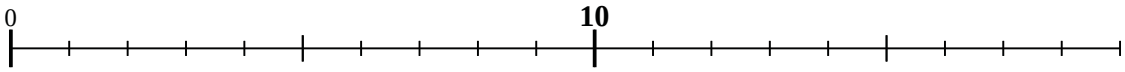

10) 50 ÷ 10 =

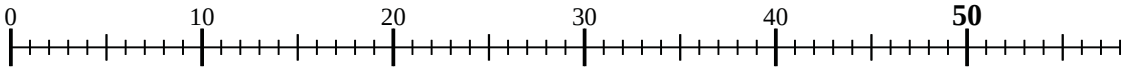

11) 18 ÷ 6 =

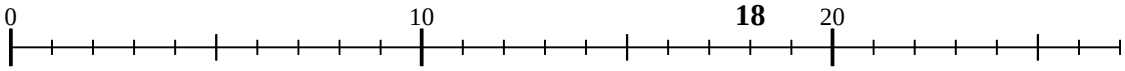

Answers

1. _____
2. _____
3. _____
4. _____
5. _____
6. _____
7. _____
8. _____
9. _____
10. _____
11. _____

1-10	91	82	73	64	55	45	36	27	18	9
11	0									

Dividing with a Numberline

Name: **Answer Key**

Use the numberline to solve each problem.

1) 9 ÷ 3 =

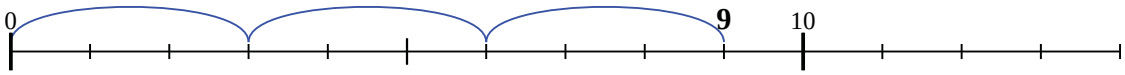

2) 12 ÷ 3 =

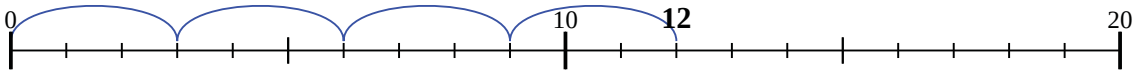

3) 6 ÷ 3 =



4) 16 ÷ 4 =

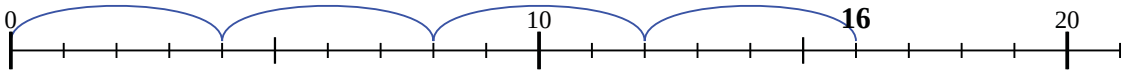

5) 20 ÷ 5 =

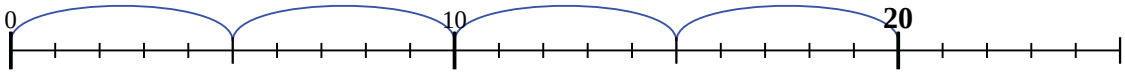

6) 24 ÷ 6 =

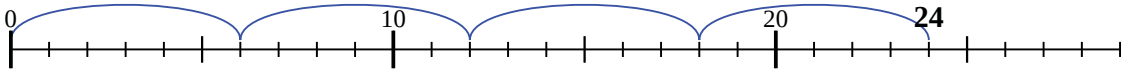

7) 40 ÷ 8 =

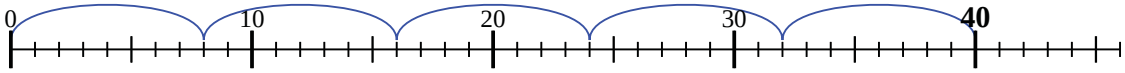

8) 36 ÷ 9 =

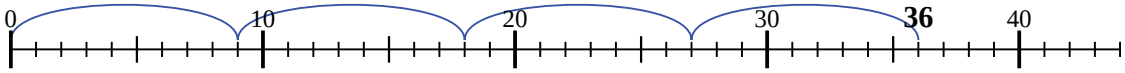

9) 10 ÷ 2 =

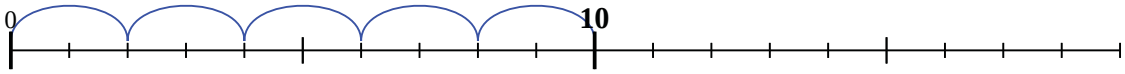

10) 50 ÷ 10 =

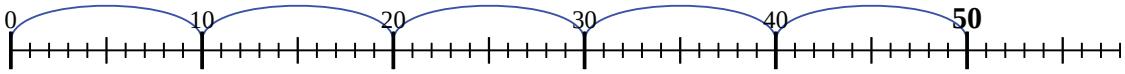

11) 18 ÷ 6 =



Answers

1. 3
2. 4
3. 2
4. 4
5. 4
6. 4
7. 5
8. 4
9. 5
10. 5
11. 3

1-10	91	82	73	64	55	45	36	27	18	9
11	0									

Dividing with a Numberline

Name:

Use the numberline to solve each problem.

1) 15 ÷ 3 =

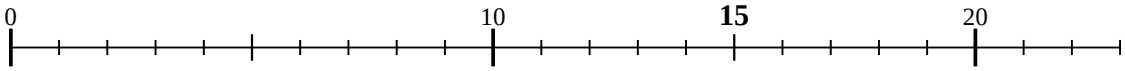

2) 24 ÷ 6 =

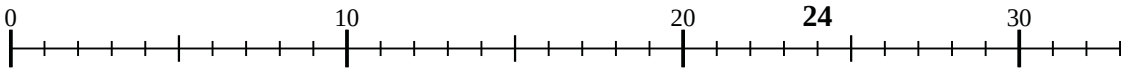

3) 21 ÷ 7 =

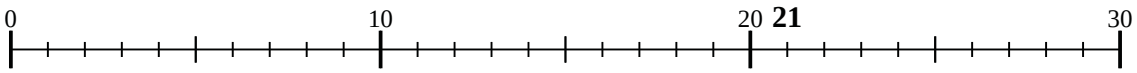

4) 20 ÷ 10 =

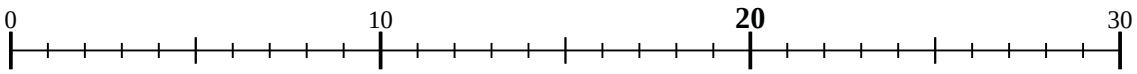

5) 25 ÷ 5 =

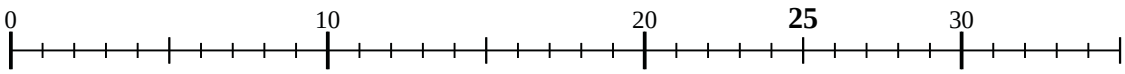

6) 18 ÷ 6 =

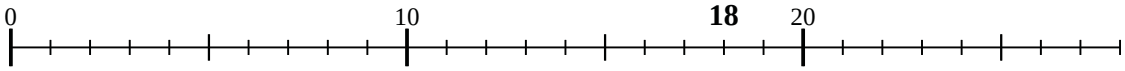

7) 40 ÷ 10 =

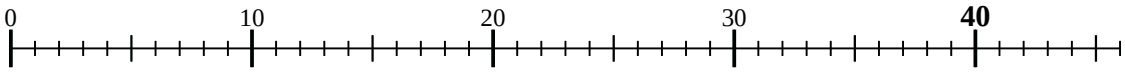

8) 12 ÷ 4 =

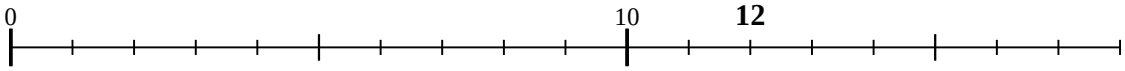

9) 8 ÷ 2 =

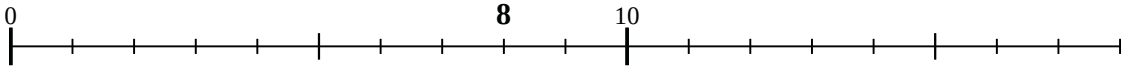

10) 40 ÷ 8 =

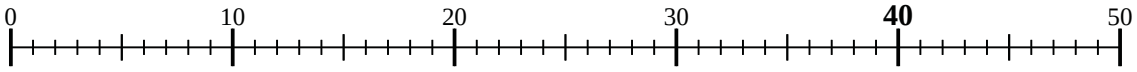

11) 8 ÷ 4 =

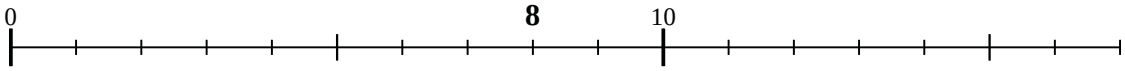

Answers

1. _____
2. _____
3. _____
4. _____
5. _____
6. _____
7. _____
8. _____
9. _____
10. _____
11. _____

1-10	91	82	73	64	55	45	36	27	18	9
11	0									

Dividing with a Numberline

Name: **Answer Key**

Use the numberline to solve each problem.

1) 15 ÷ 3 =

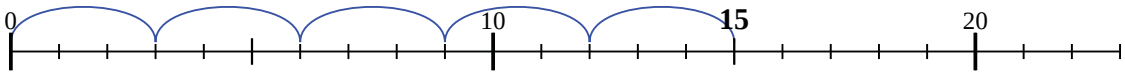

2) 24 ÷ 6 =

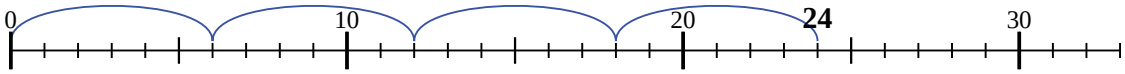

3) 21 ÷ 7 =

4) 20 ÷ 10 =

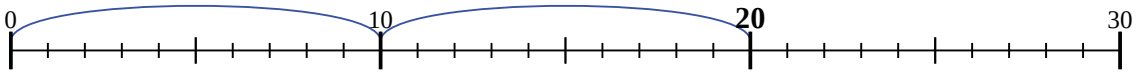

5) 25 ÷ 5 =

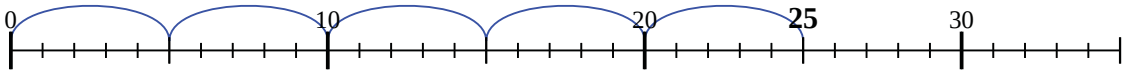

6) 18 ÷ 6 =

7) 40 ÷ 10 =

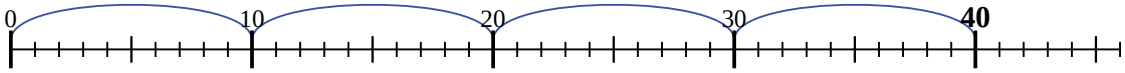

8) 12 ÷ 4 =

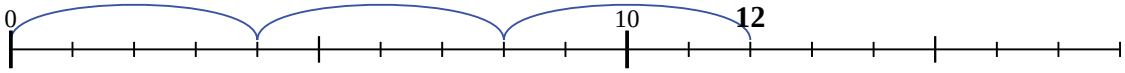

9) 8 ÷ 2 =

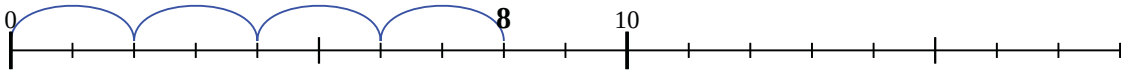

10) 40 ÷ 8 =

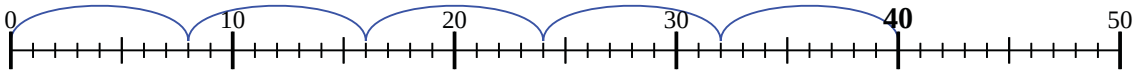

11) 8 ÷ 4 =

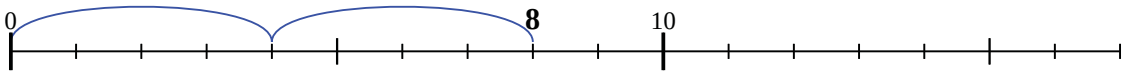

Answers

1. 5
2. 4
3. 3
4. 2
5. 5
6. 3
7. 4
8. 3
9. 4
10. 5
11. 2

1-10	91	82	73	64	55	45	36	27	18	9
11	0									

Dividing with a Numberline

Name:

Use the numberline to solve each problem.

1) 12 ÷ 6 =

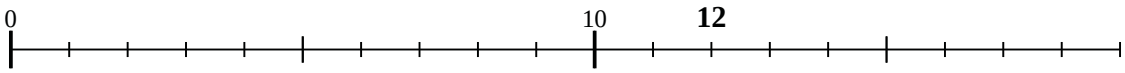

2) 27 ÷ 9 =

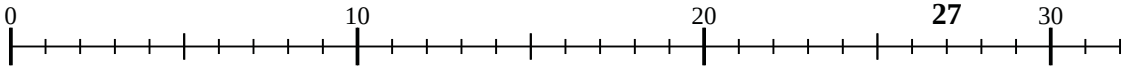

3) 40 ÷ 10 =

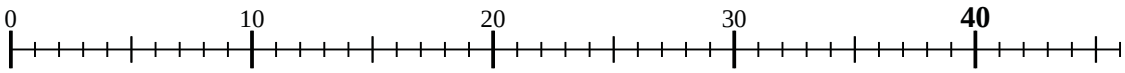

4) 24 ÷ 8 =

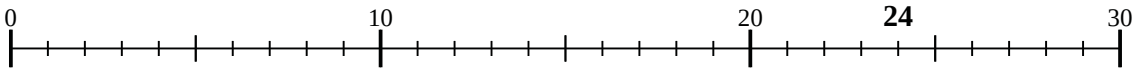

5) 15 ÷ 5 =

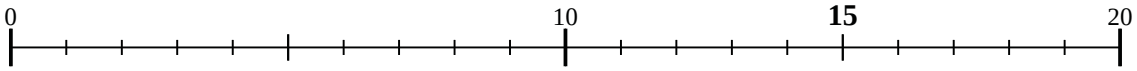

6) 16 ÷ 4 =

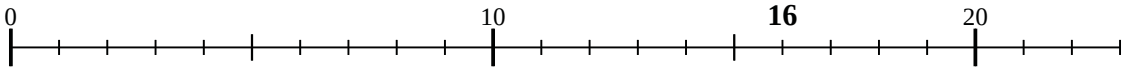

7) 8 ÷ 2 =

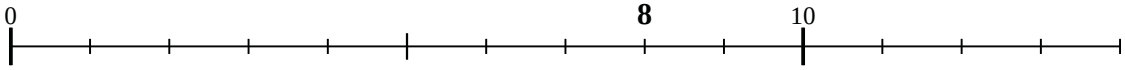

8) 6 ÷ 2 =



9) 15 ÷ 3 =

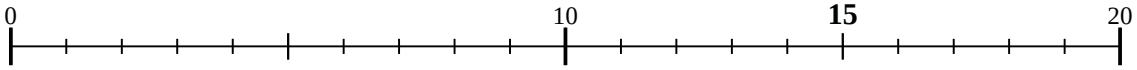

10) 18 ÷ 9 =

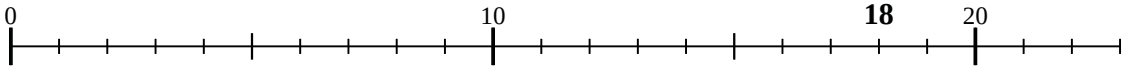

11) 20 ÷ 4 =

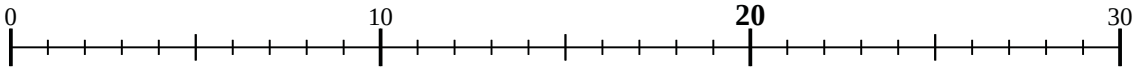

Answers

1. _____
2. _____
3. _____
4. _____
5. _____
6. _____
7. _____
8. _____
9. _____
10. _____
11. _____

1-10	91	82	73	64	55	45	36	27	18	9
11	0									

Dividing with a Numberline

Name: **Answer Key**

Use the numberline to solve each problem.

1) 12 ÷ 6 =

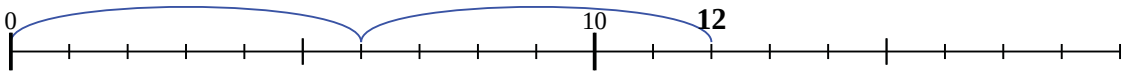

2) 27 ÷ 9 =

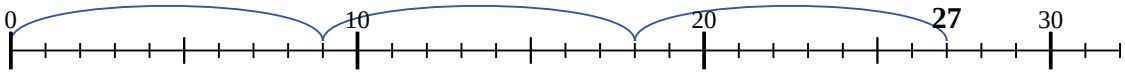

3) 40 ÷ 10 =

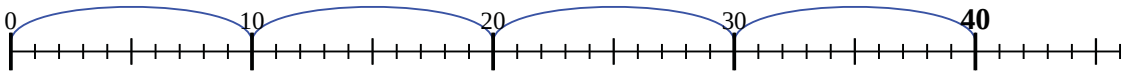

4) 24 ÷ 8 =

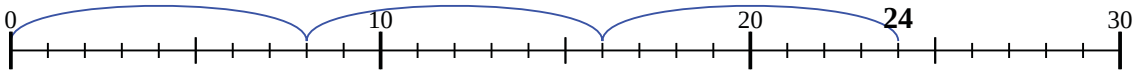

5) 15 ÷ 5 =

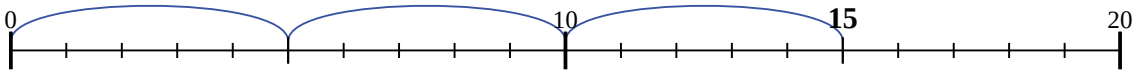

6) 16 ÷ 4 =

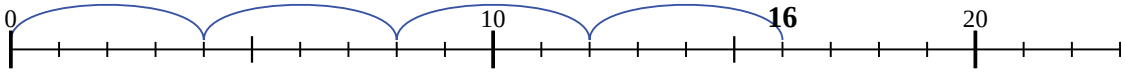

7) 8 ÷ 2 =

8) 6 ÷ 2 =

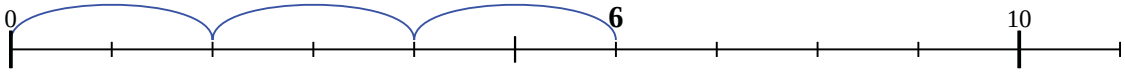

9) 15 ÷ 3 =

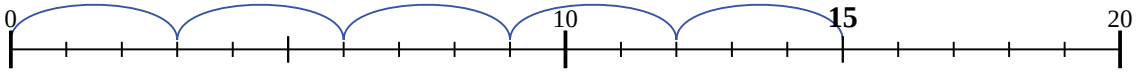

10) 18 ÷ 9 =

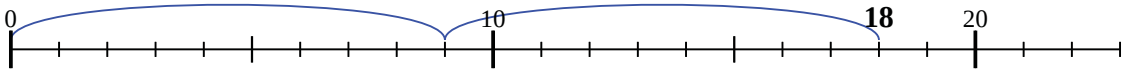

11) 20 ÷ 4 =

Answers

1. **2**
2. **3**
3. **4**
4. **3**
5. **3**
6. **4**
7. **4**
8. **3**
9. **5**
10. **2**
11. **5**

1-10	91	82	73	64	55	45	36	27	18	9
11	0									