Dividing with a Numberline

Name:

Use the numberline to solve each problem.

1) 9 ÷ 3 =

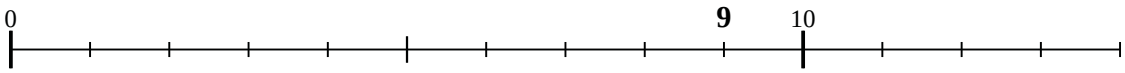

2) 12 ÷ 3 =

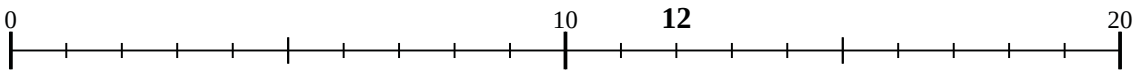

3) 6 ÷ 3 =

4) 16 ÷ 4 =

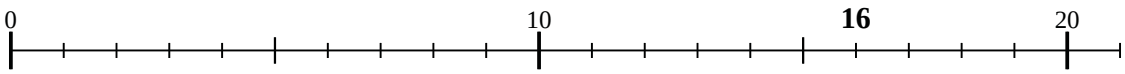

5) 20 ÷ 5 =

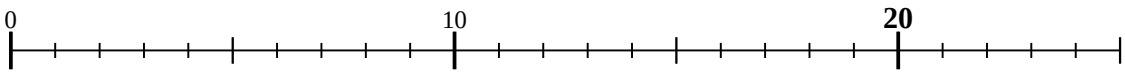

6) 24 ÷ 6 =

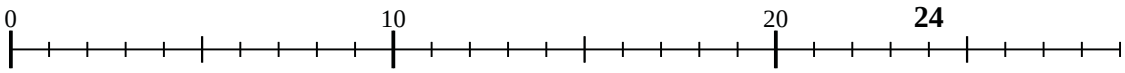

7) 40 ÷ 8 =

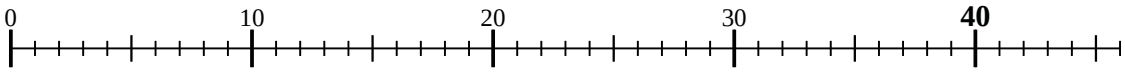

8) 36 ÷ 9 =

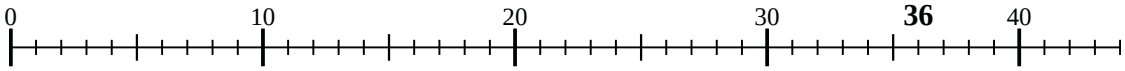

9) 10 ÷ 2 =

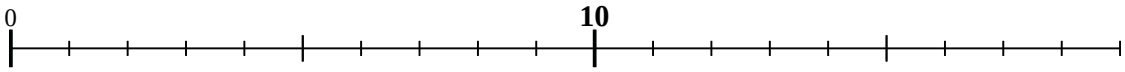

10) 50 ÷ 10 =

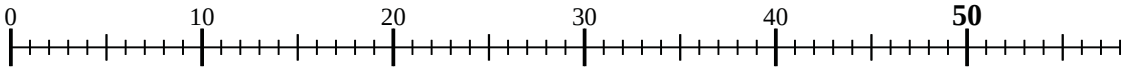

11) 18 ÷ 6 =

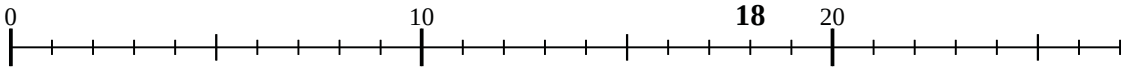

Answers

1. _____
2. _____
3. _____
4. _____
5. _____
6. _____
7. _____
8. _____
9. _____
10. _____
11. _____

1-10	91	82	73	64	55	45	36	27	18	9
11	0									

Dividing with a Numberline

Name: **Answer Key**

Use the numberline to solve each problem.

1) 9 ÷ 3 =

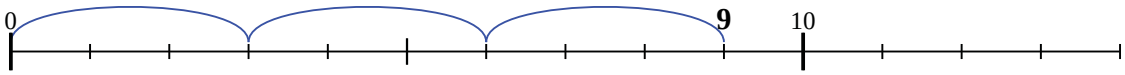

2) 12 ÷ 3 =

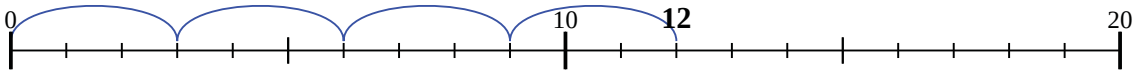

3) 6 ÷ 3 =



4) 16 ÷ 4 =

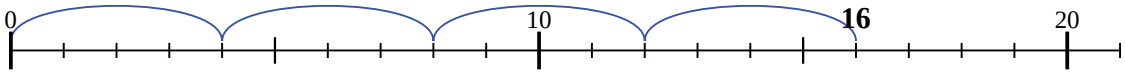

5) 20 ÷ 5 =

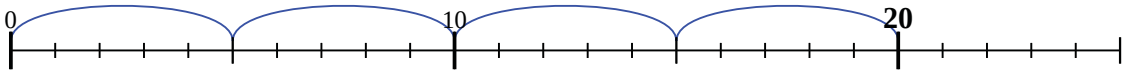

6) 24 ÷ 6 =

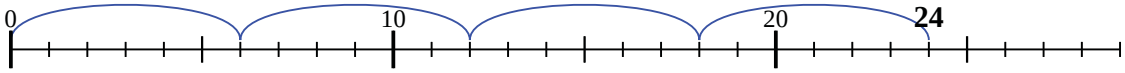

7) 40 ÷ 8 =

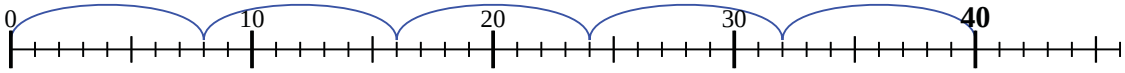

8) 36 ÷ 9 =

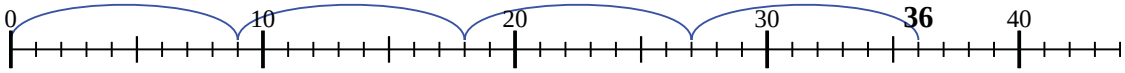

9) 10 ÷ 2 =

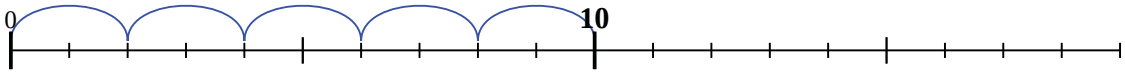

10) 50 ÷ 10 =

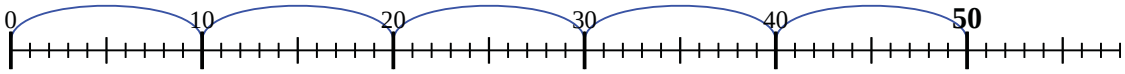

11) 18 ÷ 6 =



Answers

1. 3
2. 4
3. 2
4. 4
5. 4
6. 4
7. 5
8. 4
9. 5
10. 5
11. 3

1-10	91	82	73	64	55	45	36	27	18	9
11	0									