Dividing with a Numberline

Name:

Use the numberline to solve each problem.

1) 16 ÷ 8 =

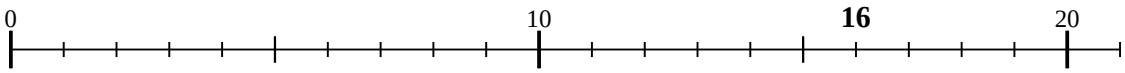

2) 35 ÷ 7 =

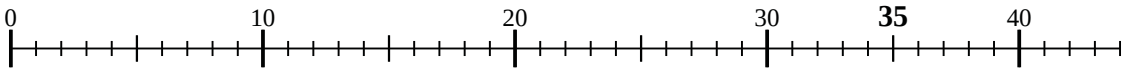

3) 30 ÷ 10 =

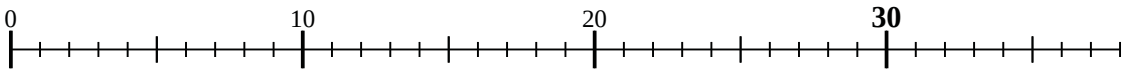

4) 36 ÷ 9 =

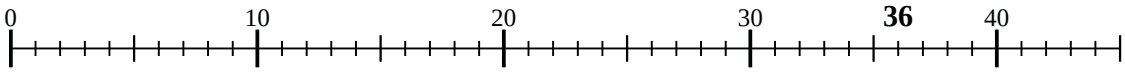

5) 27 ÷ 9 =

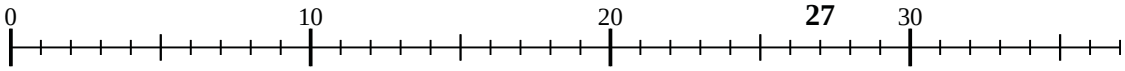

6) 20 ÷ 5 =

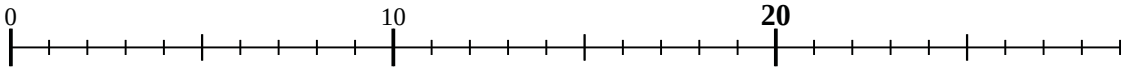

7) 20 ÷ 4 =

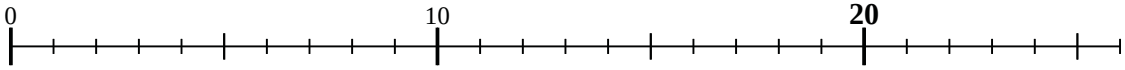

8) 18 ÷ 9 =

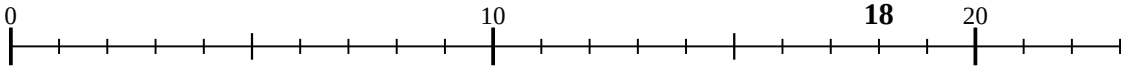

9) 20 ÷ 10 =

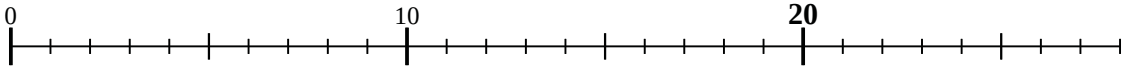

10) 12 ÷ 3 =

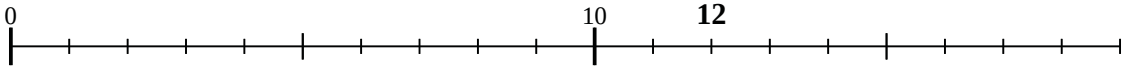

11) 15 ÷ 3 =

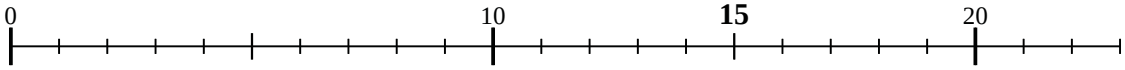

Answers

1. _____
2. _____
3. _____
4. _____
5. _____
6. _____
7. _____
8. _____
9. _____
10. _____
11. _____

1-10	91	82	73	64	55	45	36	27	18	9
11	0									

Dividing with a Numberline

Name: **Answer Key**

Use the numberline to solve each problem.

1) 16 ÷ 8 =

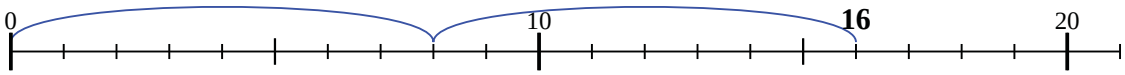

2) 35 ÷ 7 =

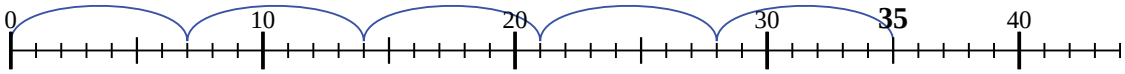

3) 30 ÷ 10 =



4) 36 ÷ 9 =

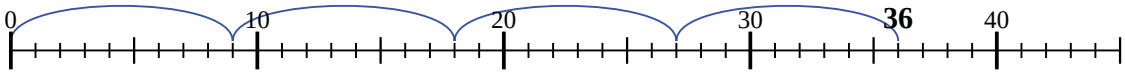

5) 27 ÷ 9 =

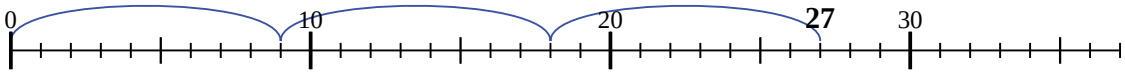

6) 20 ÷ 5 =

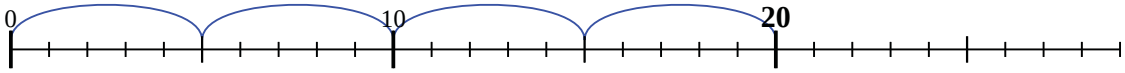

7) 20 ÷ 4 =

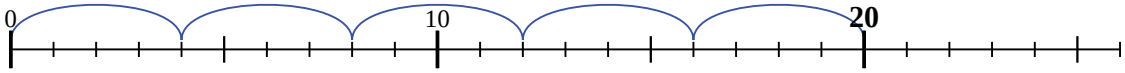

8) 18 ÷ 9 =

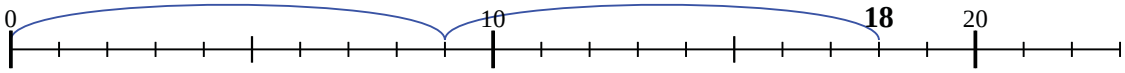

9) 20 ÷ 10 =

10) 12 ÷ 3 =

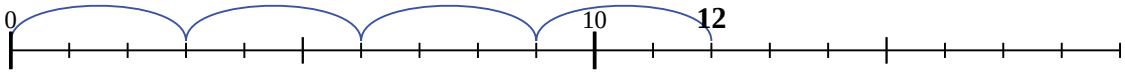

11) 15 ÷ 3 =

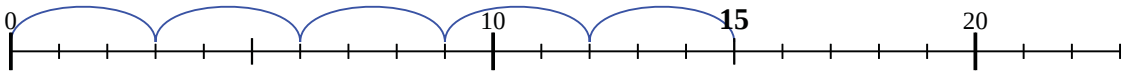

Answers

1. 2
2. 5
3. 3
4. 4
5. 3
6. 4
7. 5
8. 2
9. 2
10. 4
11. 5

1-10	91	82	73	64	55	45	36	27	18	9
11	0									