Dividing with a Numberline

Name:

Use the numberline to solve each problem.

1) 24 ÷ 6 =

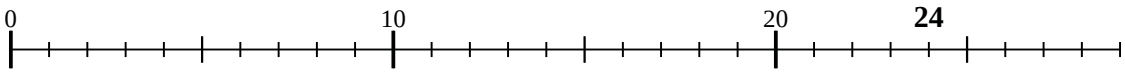

2) 25 ÷ 5 =

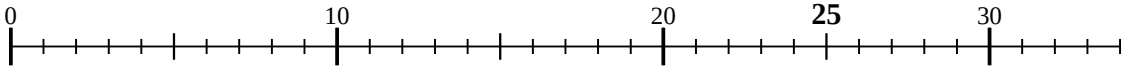

3) 9 ÷ 3 =

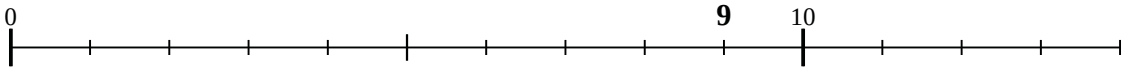

4) 12 ÷ 3 =

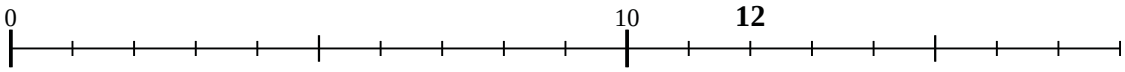

5) 50 ÷ 10 =

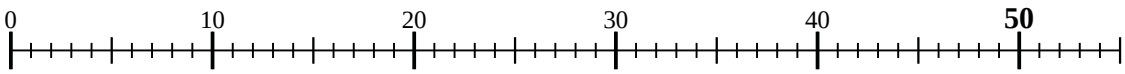

6) 15 ÷ 5 =

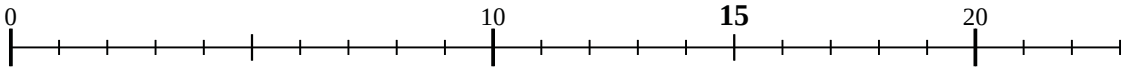

7) 20 ÷ 4 =

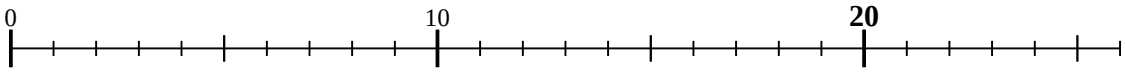

8) 36 ÷ 9 =

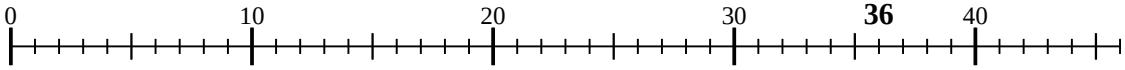

9) 20 ÷ 5 =

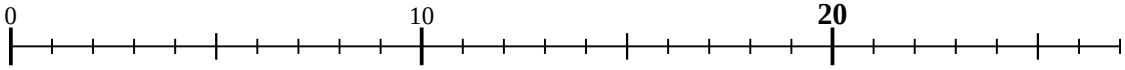

10) 8 ÷ 2 =



11) 18 ÷ 9 =

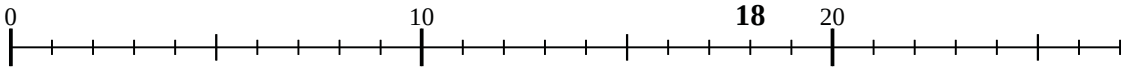

Answers

1. _____
2. _____
3. _____
4. _____
5. _____
6. _____
7. _____
8. _____
9. _____
10. _____
11. _____

1-10	91	82	73	64	55	45	36	27	18	9
11	0									

Dividing with a Numberline

Name: **Answer Key**

Use the numberline to solve each problem.

1) 24 ÷ 6 =

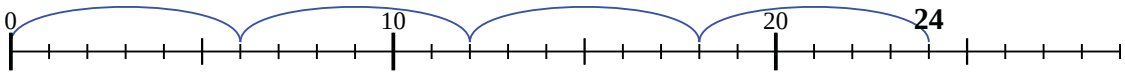

2) 25 ÷ 5 =

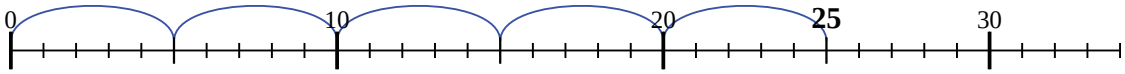

3) 9 ÷ 3 =

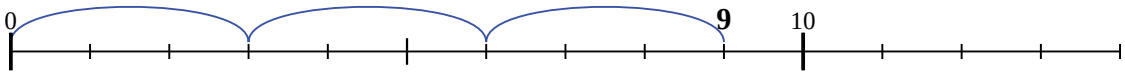

4) 12 ÷ 3 =

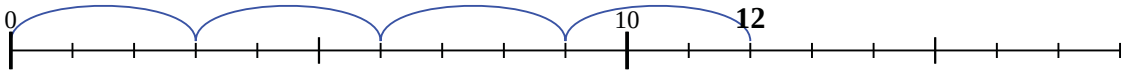

5) 50 ÷ 10 =

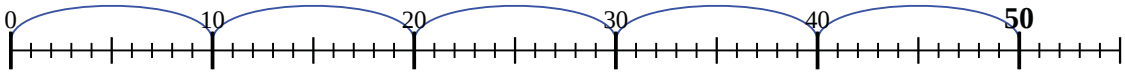

6) 15 ÷ 5 =

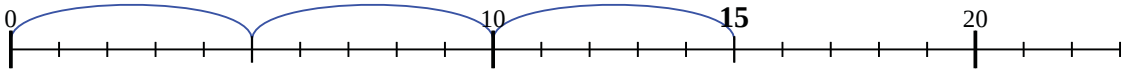

7) 20 ÷ 4 =

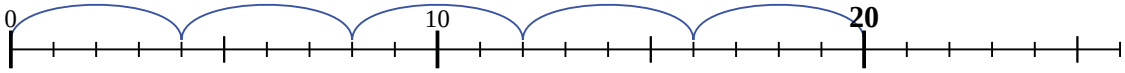

8) 36 ÷ 9 =

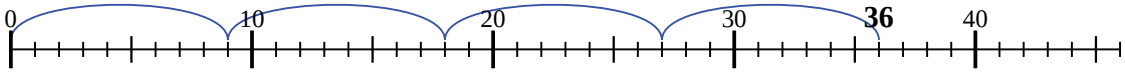

9) 20 ÷ 5 =

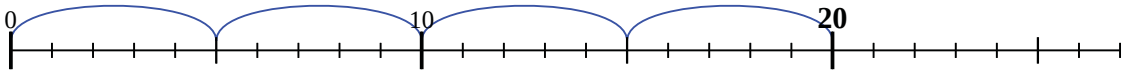

10) 8 ÷ 2 =

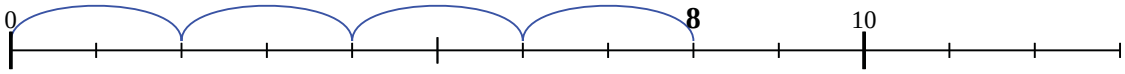

11) 18 ÷ 9 =

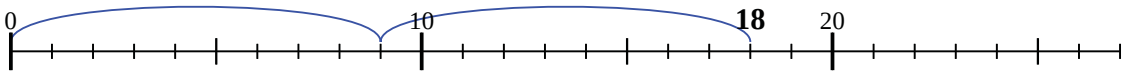

Answers

1. 4
2. 5
3. 3
4. 4
5. 5
6. 3
7. 5
8. 4
9. 4
10. 4
11. 2

1-10	91	82	73	64	55	45	36	27	18	9
11	0									