Dividing with a Numberline

Name:

Use the numberline to solve each problem.

1) 12 ÷ 6 =

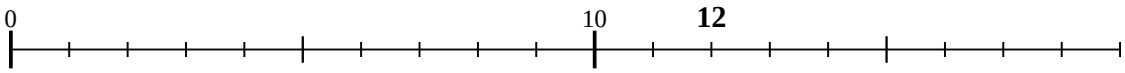

2) 27 ÷ 9 =

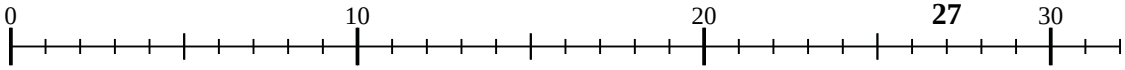

3) 40 ÷ 10 =

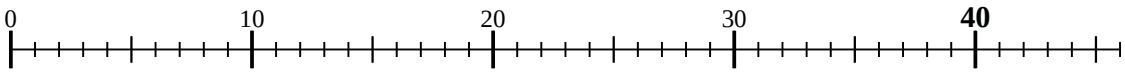

4) 24 ÷ 8 =

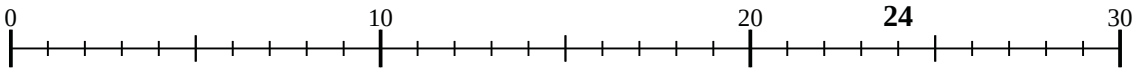

5) 15 ÷ 5 =

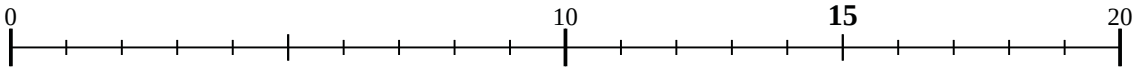

6) 16 ÷ 4 =

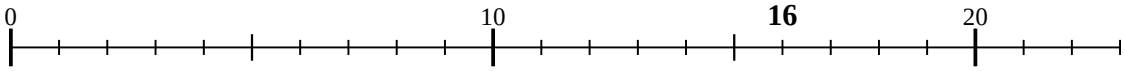

7) 8 ÷ 2 =

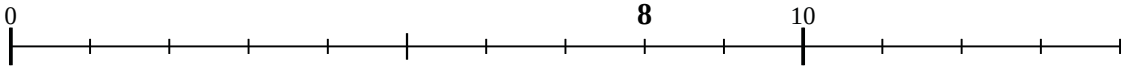

8) 6 ÷ 2 =



9) 15 ÷ 3 =

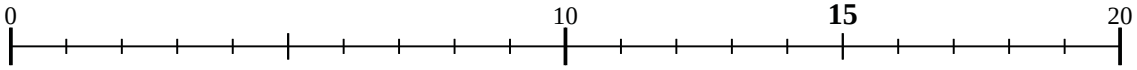

10) 18 ÷ 9 =

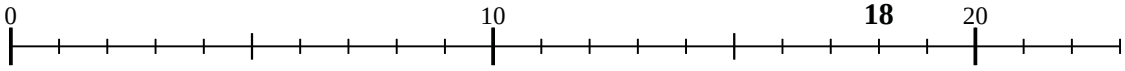

11) 20 ÷ 4 =

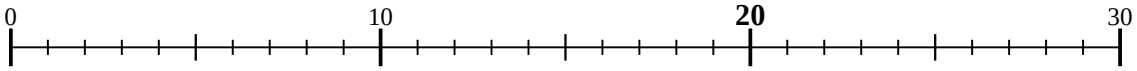

Answers

1. _____
2. _____
3. _____
4. _____
5. _____
6. _____
7. _____
8. _____
9. _____
10. _____
11. _____

1-10	91	82	73	64	55	45	36	27	18	9
11	0									

Dividing with a Numberline

Name: **Answer Key**

Use the numberline to solve each problem.

1) 12 ÷ 6 =

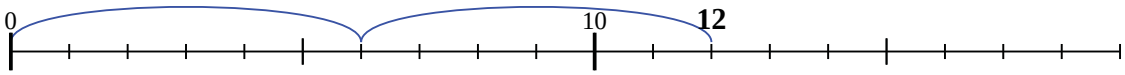

2) 27 ÷ 9 =

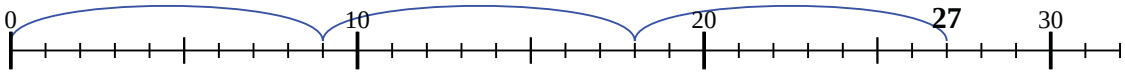

3) 40 ÷ 10 =

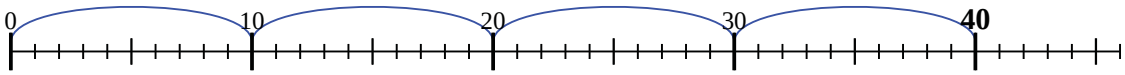

4) 24 ÷ 8 =

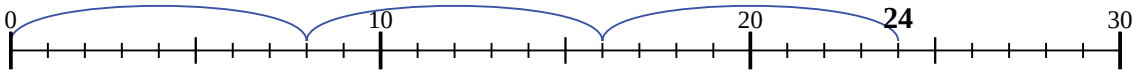

5) 15 ÷ 5 =

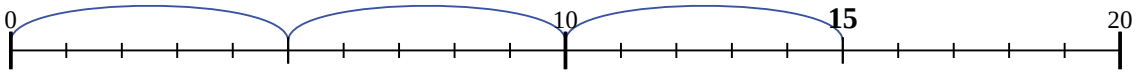

6) 16 ÷ 4 =

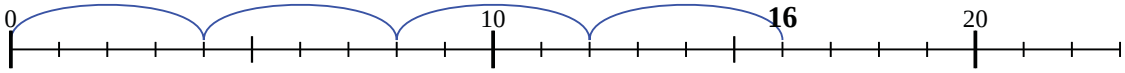

7) 8 ÷ 2 =

8) 6 ÷ 2 =

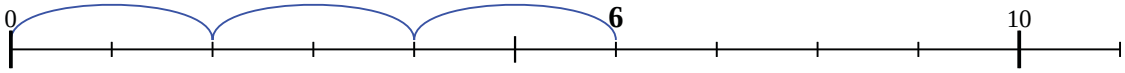

9) 15 ÷ 3 =

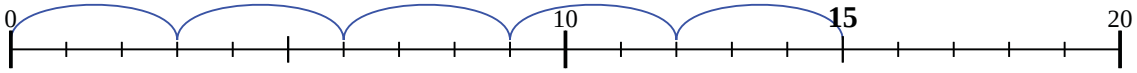

10) 18 ÷ 9 =

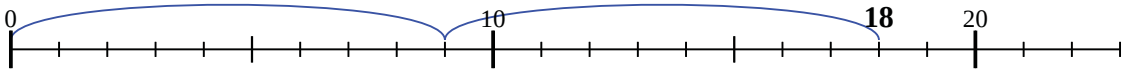

11) 20 ÷ 4 =

Answers

1. **2**
2. **3**
3. **4**
4. **3**
5. **3**
6. **4**
7. **4**
8. **3**
9. **5**
10. **2**
11. **5**

1-10	91	82	73	64	55	45	36	27	18	9
11	0									