# Visual Place Value (Less than 20)

Name:

**Fill in the blanks to find the amounts.**

**Ex)**

0 tens 4 ones

**1)**

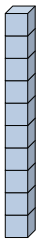

_____ tens _____ ones

**2)**

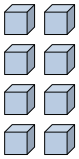

_____ tens _____ ones

**3)**

_____ tens _____ ones

**4)**

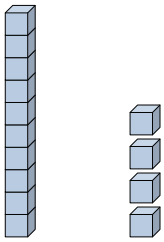

_____ tens _____ ones

**5)**

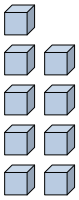

_____ tens _____ ones

**6)**

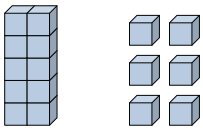

_____ tens _____ ones

**7)**

_____ tens _____ ones

**8)**

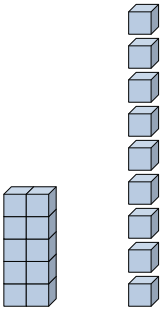

_____ tens _____ ones

**9)**

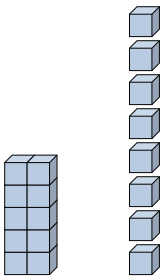

_____ tens _____ ones

**10)**

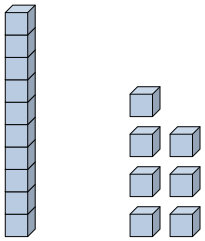

_____ tens _____ ones

**11)**

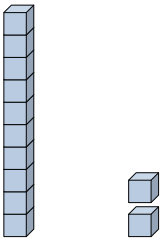

_____ tens _____ ones

## Answers

Ex. 4

1. _____
2. _____
3. _____
4. _____
5. _____
6. _____
7. _____
8. _____
9. _____
10. _____
11. _____

Visual Place Value (Less than 20) Name: **Answer Key**

**Fill in the blanks to find the amounts.**

**Ex)**

0 tens 4 ones

**1)**

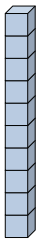

1 tens 0 ones

**2)**

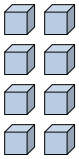

0 tens 8 ones

**3)**

0 tens 2 ones

**4)**

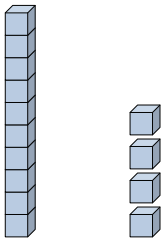

1 tens 4 ones

**5)**

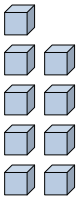

0 tens 9 ones

**6)**

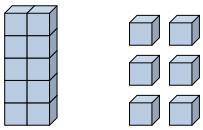

1 tens 6 ones

**7)**

0 tens 3 ones

**8)**

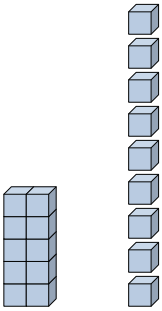

1 tens 9 ones

**9)**

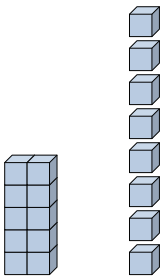

1 tens 8 ones

**10)**

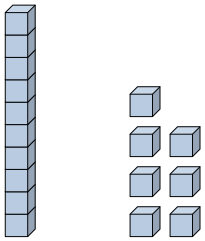

1 tens 7 ones

**11)**

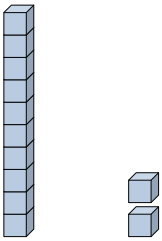

1 tens 2 ones

## Answers

| | |
|---|---|
| Ex. | 4 |
| 1. | 10 |
| 2. | 8 |
| 3. | 2 |
| 4. | 14 |
| 5. | 9 |
| 6. | 16 |
| 7. | 3 |
| 8. | 19 |
| 9. | 18 |
| 10. | 17 |
| 11. | 12 |